Определение значения по блокам Имя:

Найдите значение, которое представлено блоками.

1) 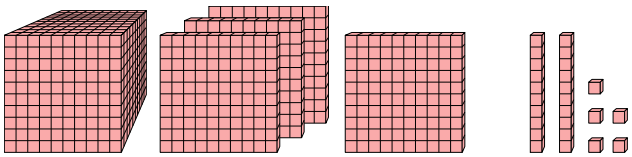

2) 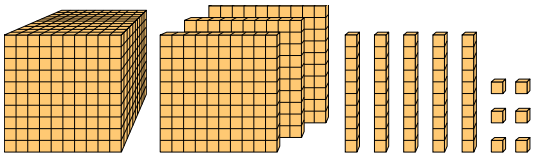

3) 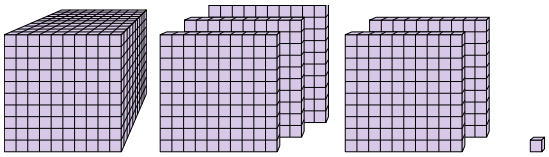

4) 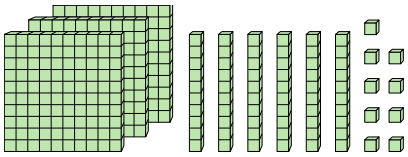

5) 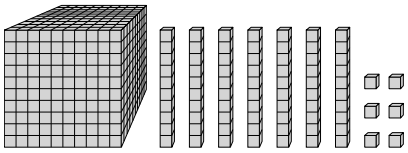

6) 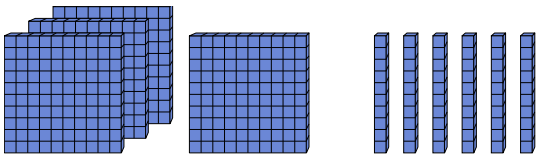

7) 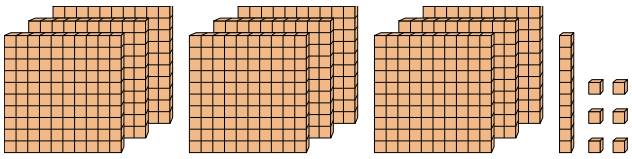

8) 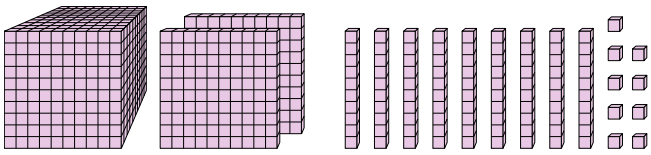

9) 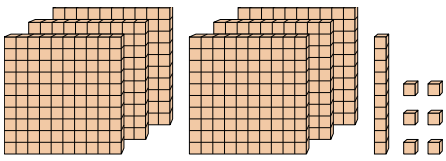

10) 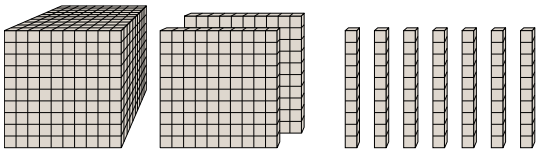

Ответы

1. _____
2. _____
3. _____
4. _____
5. _____
6. _____
7. _____
8. _____
9. _____
10. _____

1-10	90	80	70	60	50	40	30	20	10	0

Определение значения по блокам

Имя: **Ключ к правильным ответам**

Найдите значение, которое представлено блоками.

1) 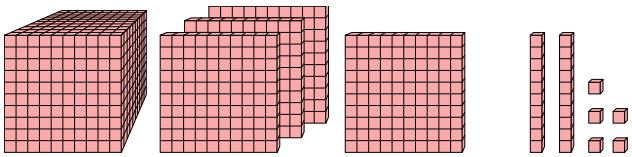

2) 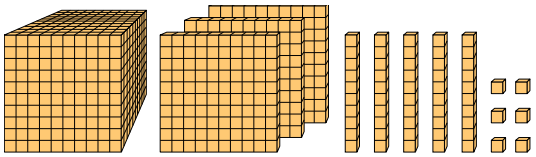

3) 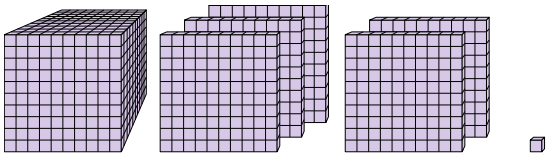

4) 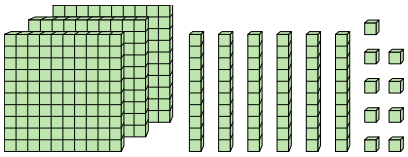

5) 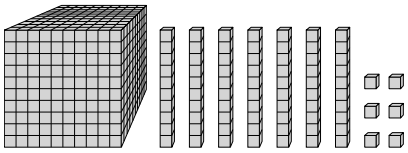

6) 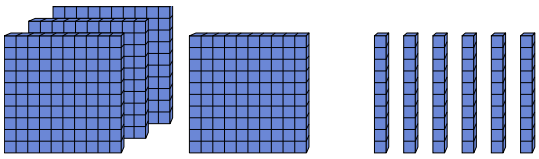

7) 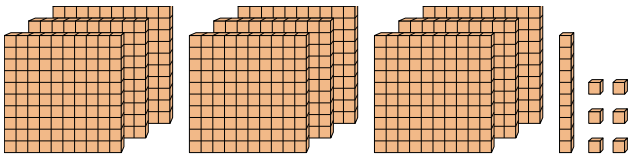

8) 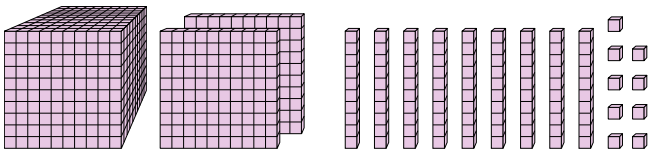

9) 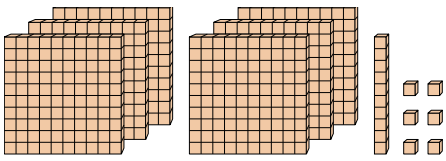

10) 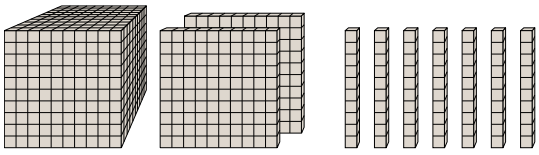

Ответы

1. **1 425**
2. **1 356**
3. **1 501**
4. **369**
5. **1 076**
6. **460**
7. **916**
8. **1 299**
9. **616**
10. **1 270**

1-10	90	80	70	60	50	40	30	20	10	0