Определение значения по блокам Имя:

Подсчитайте общее число маленьких блоков.

1) 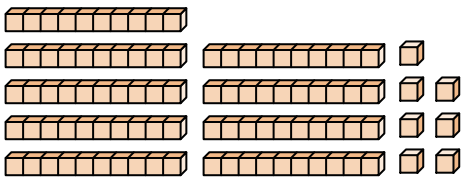

2) 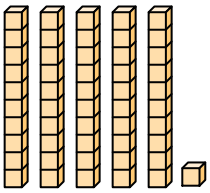

3) 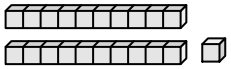

4) 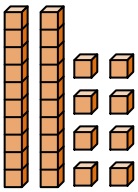

5) 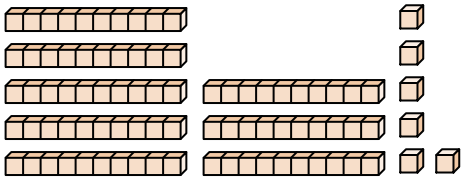

6) 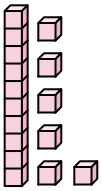

7) 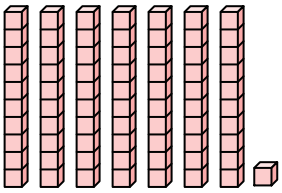

8) 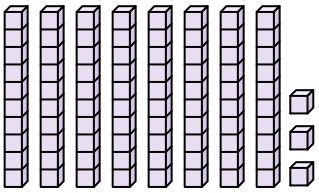

9) 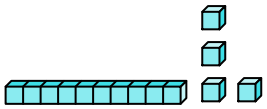

10) 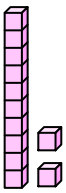

11) 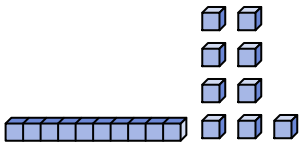

12) 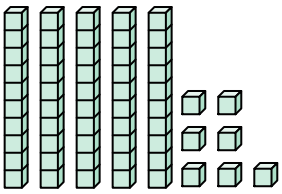

Ответы

1. _____
2. _____
3. _____
4. _____
5. _____
6. _____
7. _____
8. _____
9. _____
10. _____
11. _____
12. _____

1-10	92	83	75	67	58	50	42	33	25	17
11-12	8	0								

Определение значения по блокам

Имя: **Ключ к правильным ответам**

Подсчитайте общее число маленьких блоков.

1)

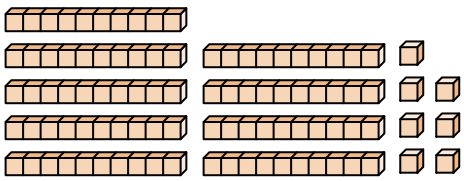

2)

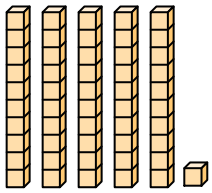

3)

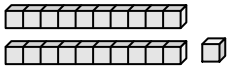

4)

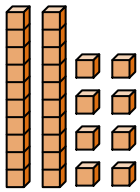

5)

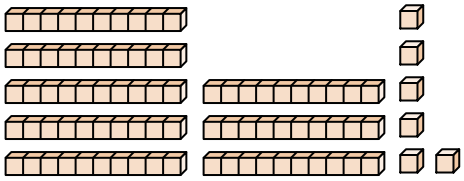

6)

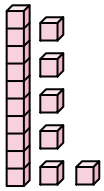

7)

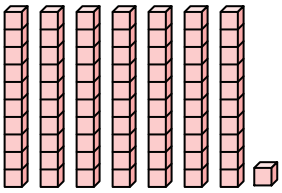

8)

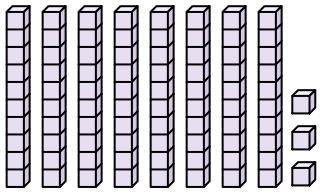

9)

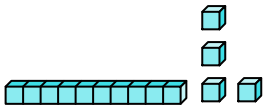

10)

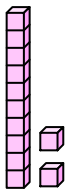

11)

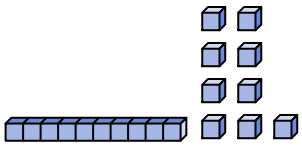

12)

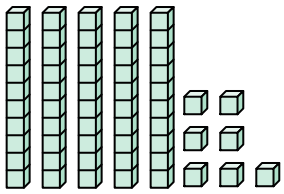

Ответы

1. **97**
2. **51**
3. **21**
4. **28**
5. **86**
6. **16**
7. **71**
8. **83**
9. **14**
10. **12**
11. **19**
12. **57**

1-10	92	83	75	67	58	50	42	33	25	17
11-12	8	0								

Определение значения по блокам Имя:

Подсчитайте общее число маленьких блоков.

51	16	86	21	28
12	83	97	14	71

1)

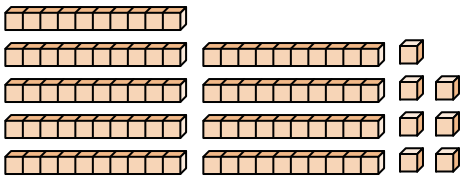

2)

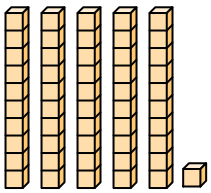

3)

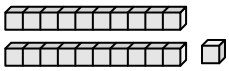

4)

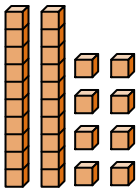

5)

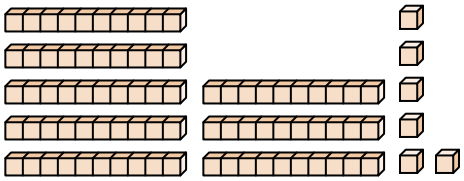

6)

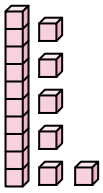

7)

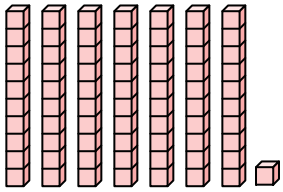

8)

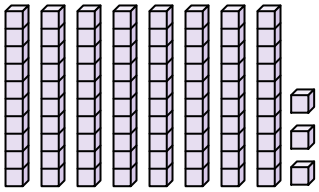

9)

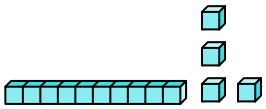

10)

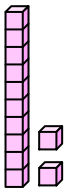

Ответы

1. _____
2. _____
3. _____
4. _____
5. _____
6. _____
7. _____
8. _____
9. _____
10. _____

1-10	90	80	70	60	50	40	30	20	10	0