Изображение часов Имя:

Изобразите часовые и минутные стрелки на часах так, как это представлено.

1) 11:20



2) 6:25

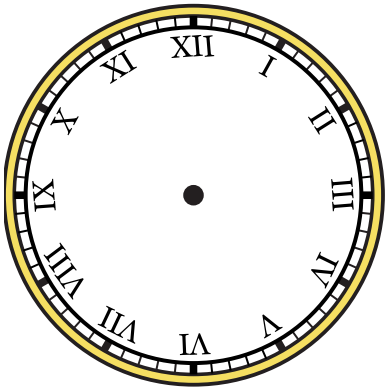

3) 8:50



4) 4:40

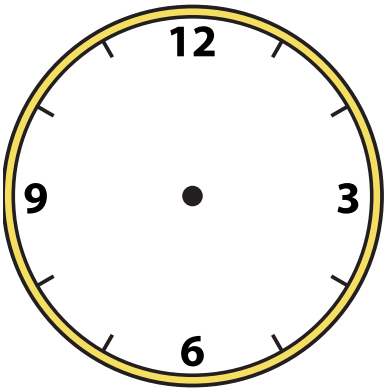

5) 11:50

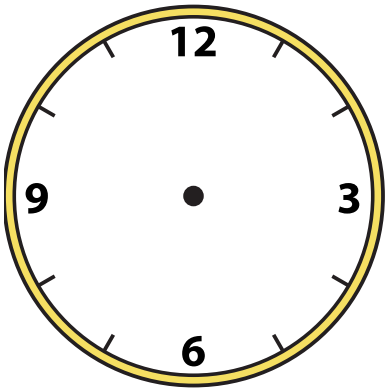

6) 11:45

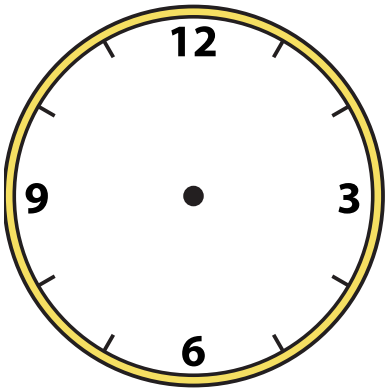

7) 10:50

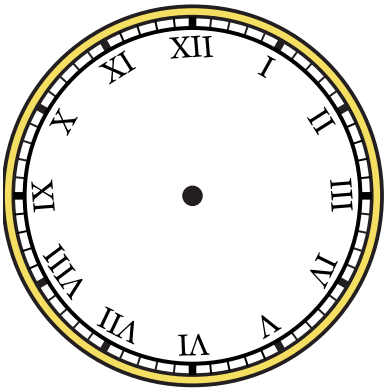

8) 5:40



9) 8:30

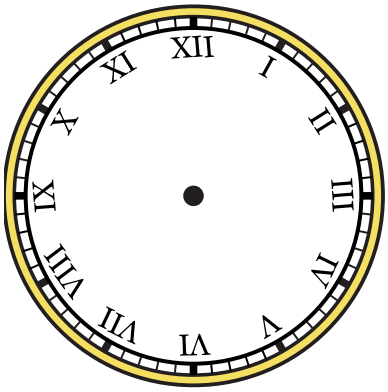

1-9	89	78	67	56	44	33	22	11	0

Изобразите часовые и минутные стрелки на часах так, как это представлено.

1) 11:20

2) 6:25



3) 8:50

4) 4:40

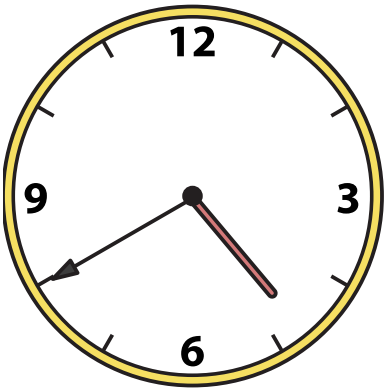

5) 11:50



6) 11:45



7) 10:50



8) 5:40

9) 8:30



1-9	89	78	67	56	44	33	22	11	0