Изобразите часовые и минутные стрелки на часах так, как это представлено.

1) 12:10

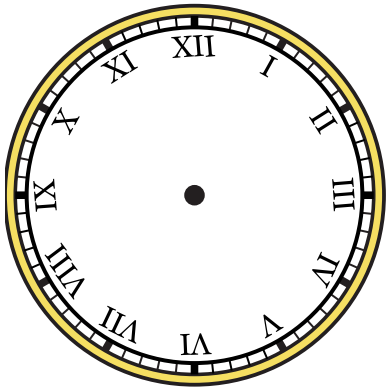

2) 9:35

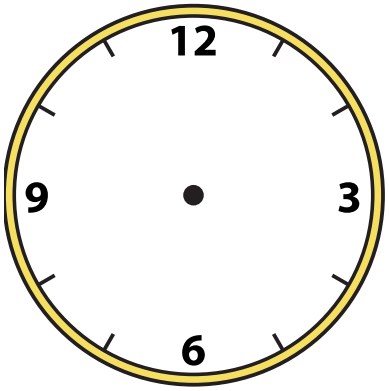

3) 8:50

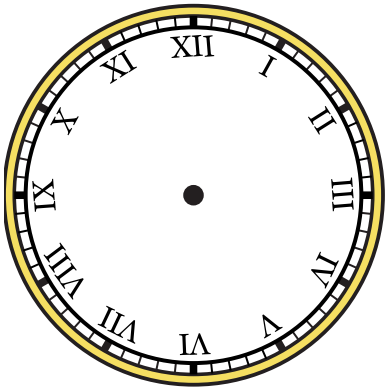

4) 2:50



5) 10:55



6) 4:40

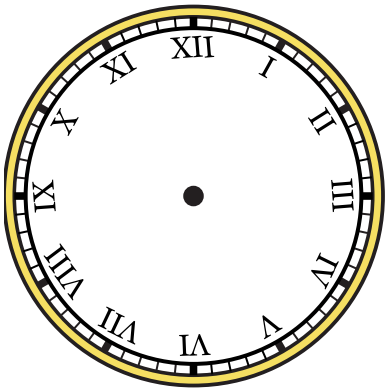

7) 5:50

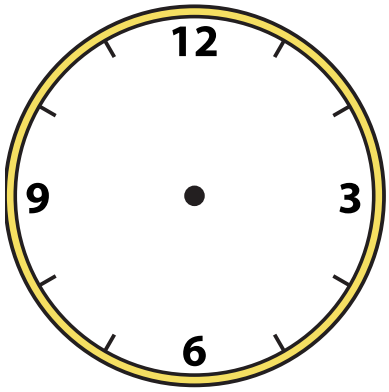

8) 11:35



9) 9:45

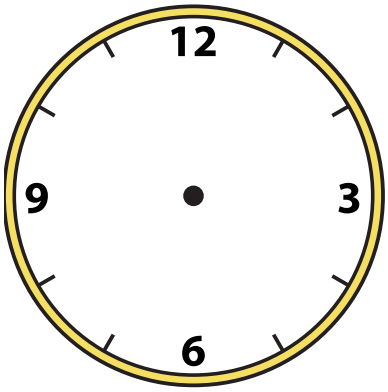

1-9	89	78	67	56	44	33	22	11	0

Изобразите часовые и минутные стрелки на часах так, как это представлено.

1) 12:10



2) 9:35

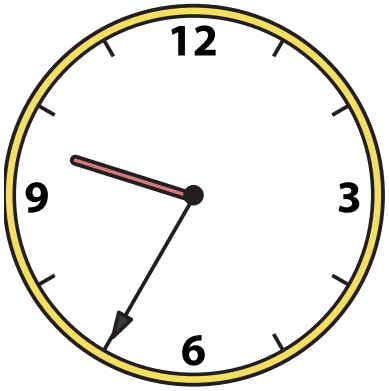

3) 8:50



4) 2:50

5) 10:55

6) 4:40

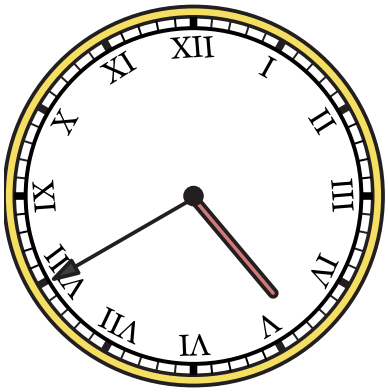

7) 5:50



8) 11:35

9) 9:45

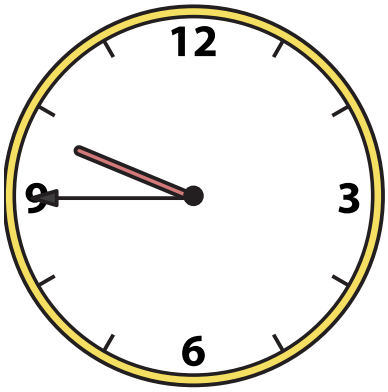

1-9	89	78	67	56	44	33	22	11	0