**Изобразите часовые и минутные стрелки на часах так, чтобы они показывали определенное время.**

**1)** 3:45

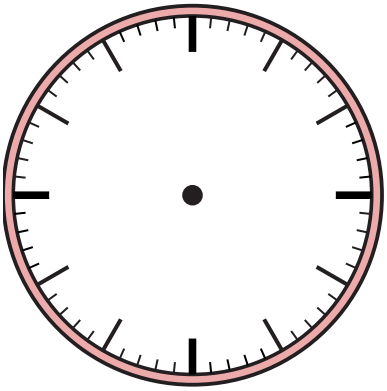

**2)** 3:13

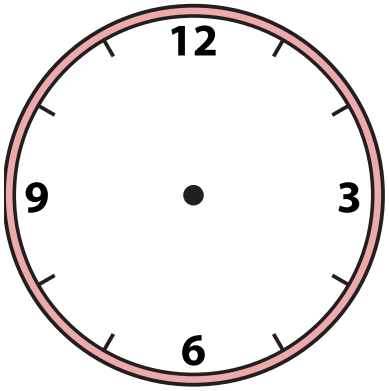


**3)** 4:41

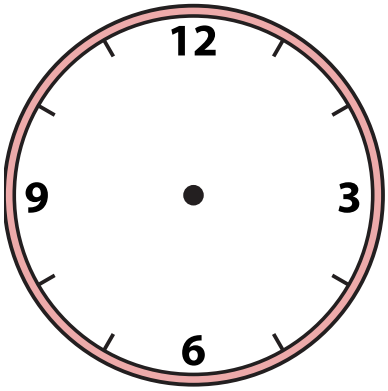


**4)** 8:34

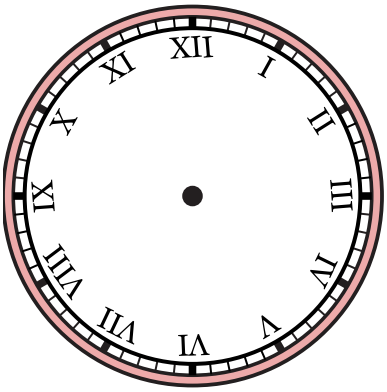


**5)** 1:47

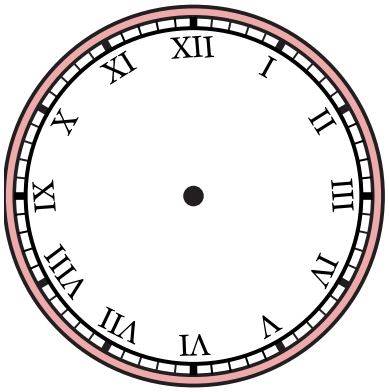


**6)** 9:20

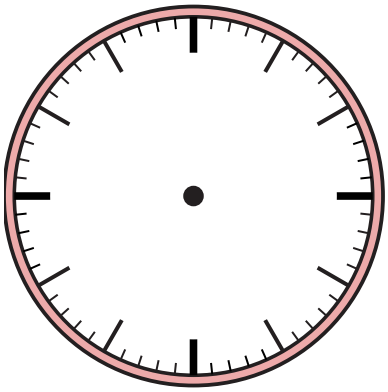

**7)** 7:22

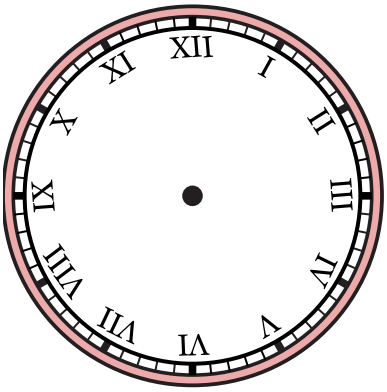


**8)** 4:56

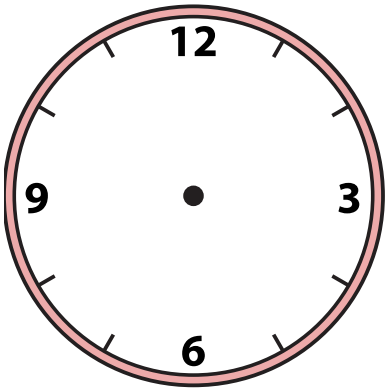


**9)** 5:13

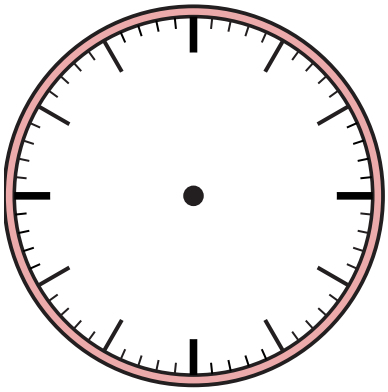



| 1-9 | 89 | 78 | 67 | 56 | 44 | 33 | 22 | 11 | 0 |
|---|---|---|---|---|---|---|---|---|---|

**Изобразите часовые и минутные стрелки на часах так, чтобы они показывали определенное время.**

**1)** 3:45



**2)** 3:13




**3)** 4:41




**4)** 8:34




**5)** 1:47




**6)** 9:20

**7)** 7:22

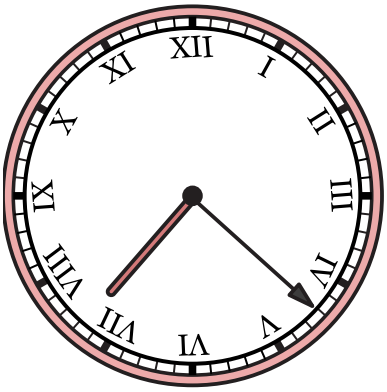


**8)** 4:56




**9)** 5:13

| 1-9 | 89 | 78 | 67 | 56 | 44 | 33 | 22 | 11 | 0 |
|---|---|---|---|---|---|---|---|---|---|