**Изобразите часовые и минутные стрелки на часах так, как это представлено.**

**1)** 6:00

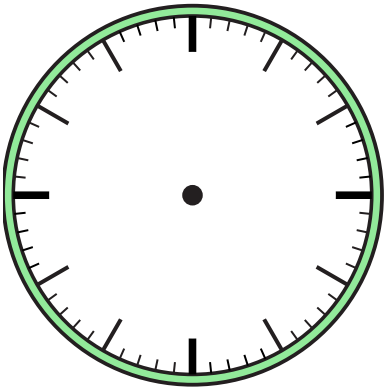

**2)** 11:30

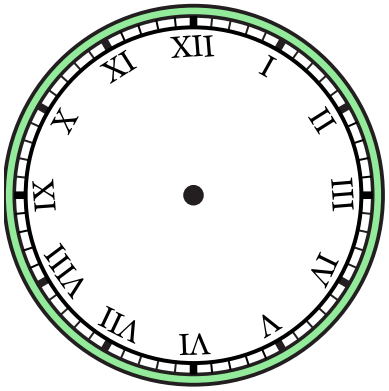


**3)** 12:00

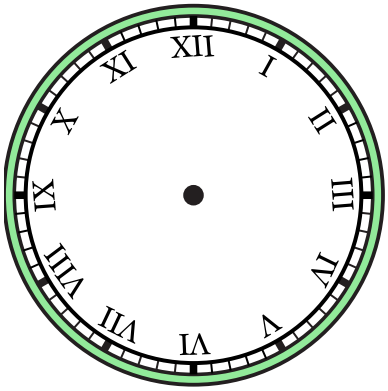


**4)** 9:00

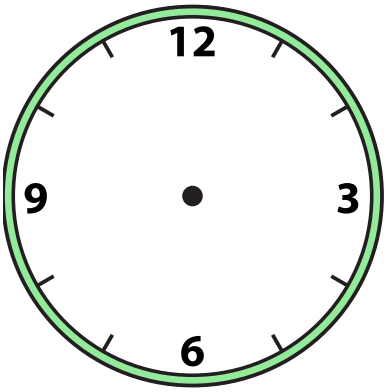


**5)** 12:00

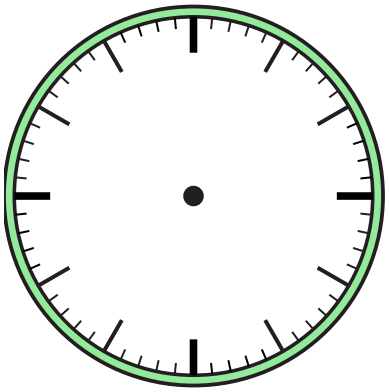

**6)** 6:30

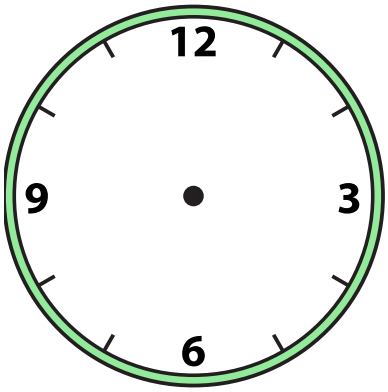


**7)** 10:30

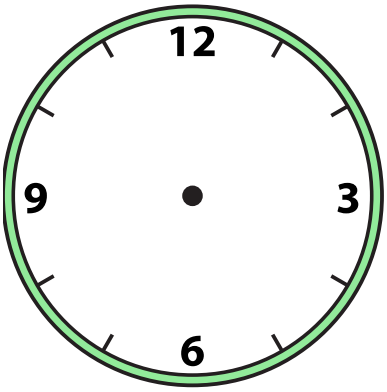


**8)** 3:00

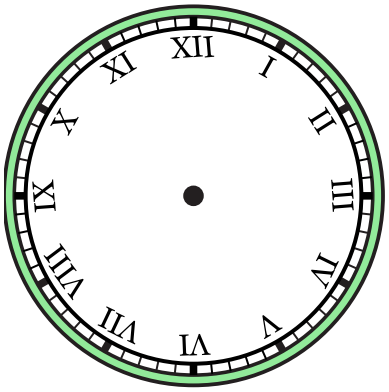


**9)** 11:00

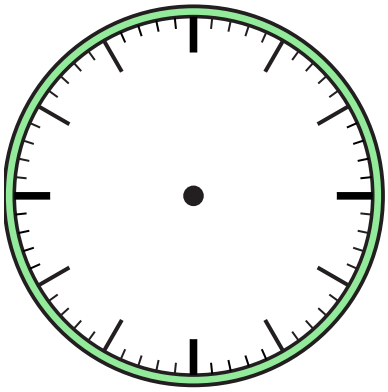



| 1-9 | 89 | 78 | 67 | 56 | 44 | 33 | 22 | 11 | 0 |
|---|---|---|---|---|---|---|---|---|---|

**Изобразите часовые и минутные стрелки на часах так, как это представлено.**

1) 6:00

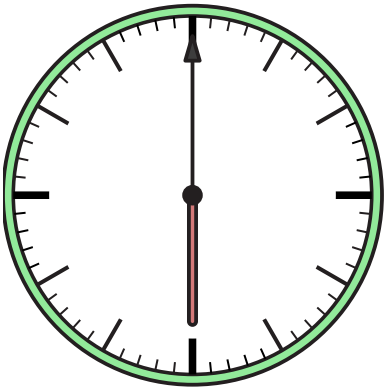

2) 11:30

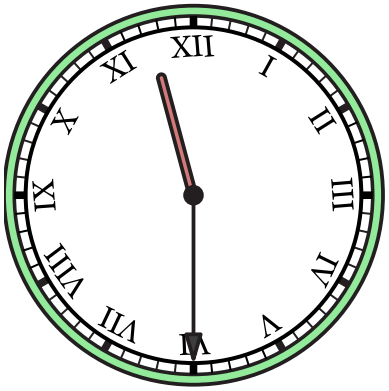


3) 12:00

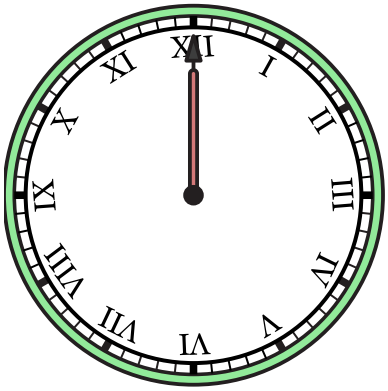


4) 9:00




5) 12:00

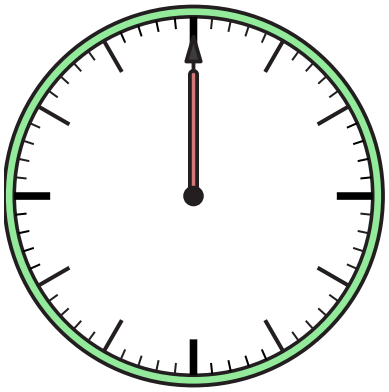

6) 6:30




7) 10:30




8) 3:00

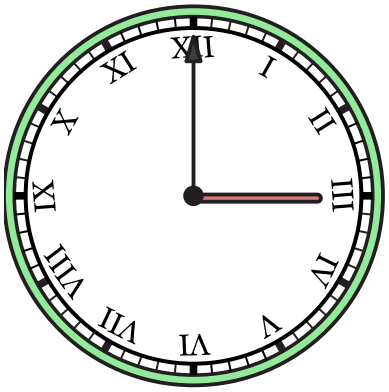


9) 11:00





| 1-9 | 89 | 78 | 67 | 56 | 44 | 33 | 22 | 11 | 0 |
|---|---|---|---|---|---|---|---|---|---|