Использование перспективы Имя:

Решите каждую задачу.

Ответы

1. _____
2. _____
3. _____
4. _____
5. _____

1) Если вы посмотрите на фигуру 3d с правой стороны, то что вы увидите?

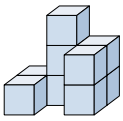

A. 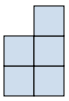

B.

C. 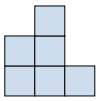

D. 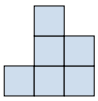

2) Если вы посмотрите на фигуру 3d с правой стороны, то что вы увидите?

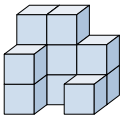

A. 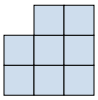

B. 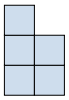

C. 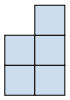

D.

3) Если вы посмотрите на фигуру 3d с левой стороны, то что вы увидите?

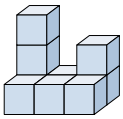

A. 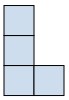

B. 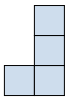

C.

D. 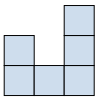

4) Если вы посмотрите на фигуру 3d с правой стороны, то что вы увидите?

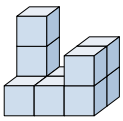

A. 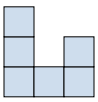

B. 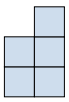

C. 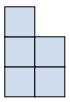

D. 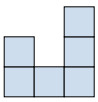

5) Если вы посмотрите на фигуру 3d с левой стороны, то что вы увидите?

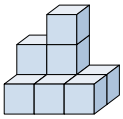

A. 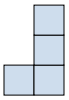

B. 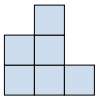

C. 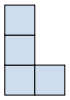

D.

1-5	80	60	40	20	0

Решите каждую задачу.

1) Если вы посмотрите на фигуру 3d с правой стороны, то что вы увидите?

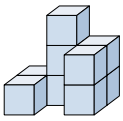

A. 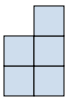

B.

C. 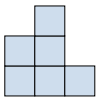

D. 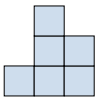

2) Если вы посмотрите на фигуру 3d с правой стороны, то что вы увидите?

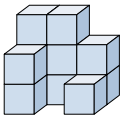

A. 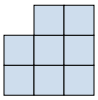

B. 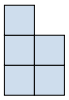

C. 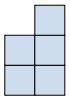

D.

3) Если вы посмотрите на фигуру 3d с левой стороны, то что вы увидите?

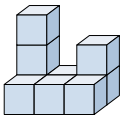

A. 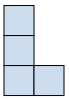

B. 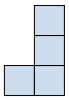

C.

D. 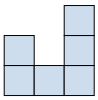

4) Если вы посмотрите на фигуру 3d с правой стороны, то что вы увидите?

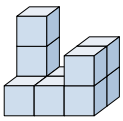

A. 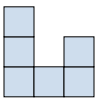

B. 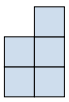

C. 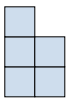

D. 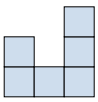

5) Если вы посмотрите на фигуру 3d с левой стороны, то что вы увидите?

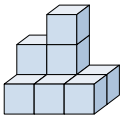

A. 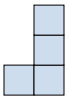

B. 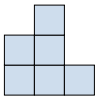

C. 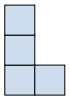

D.

Ответы

1. A
2. C
3. A
4. B
5. C

1-5	80	60	40	20	0