Использование перспективы Имя:

Решите каждую задачу.

Ответы

1. _____
2. _____
3. _____
4. _____
5. _____

1) Если вы посмотрите на фигуру 3d сверху, то что вы увидите?

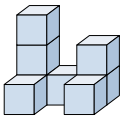

A.

B. 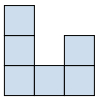

C. 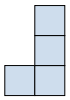

D. 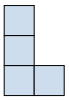

2) Если вы посмотрите на фигуру 3d сверху, то что вы увидите?

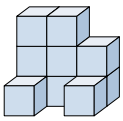

A. 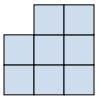

B. 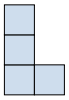

C.

D. 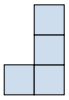

3) Если вы посмотрите на фигуру 3d с правой стороны, то что вы увидите?

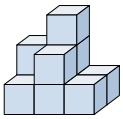

A.

B. 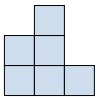

C. 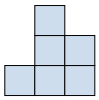

D. 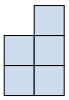

4) Если вы посмотрите на фигуру 3d сверху, то что вы увидите?

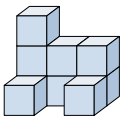

A.

B. 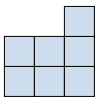

C. 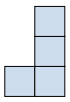

D. 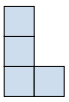

5) Если вы посмотрите на фигуру 3d сверху, то что вы увидите?

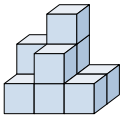

A. 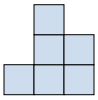

B. 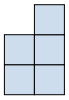

C.

D. 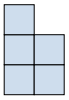

1-5	80	60	40	20	0

Решите каждую задачу.

1) Если вы посмотрите на фигуру 3d сверху, то что вы увидите?

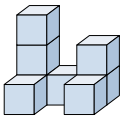

A.

B. 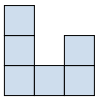

C. 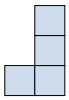

D. 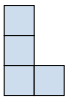

2) Если вы посмотрите на фигуру 3d сверху, то что вы увидите?

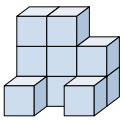

A. 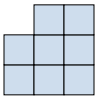

B. 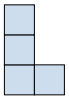

C.

D. 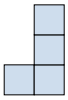

3) Если вы посмотрите на фигуру 3d с правой стороны, то что вы увидите?

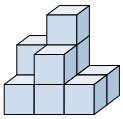

A.

B. 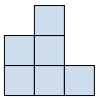

C. 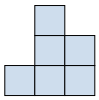

D. 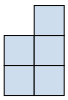

4) Если вы посмотрите на фигуру 3d сверху, то что вы увидите?

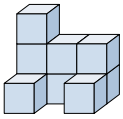

A.

B. 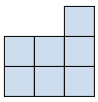

C. 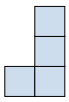

D. 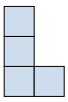

5) Если вы посмотрите на фигуру 3d сверху, то что вы увидите?

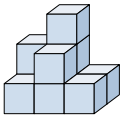

A. 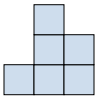

B. 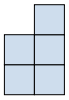

C.

D. 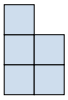

Ответы

1. A
2. C
3. D
4. A
5. C

1-5	80	60	40	20	0

Решите каждую задачу.

1) Если вы посмотрите на фигуру 3d с правой стороны, то что вы увидите?

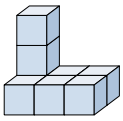

A. 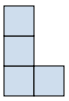

B. 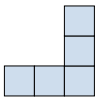

C. 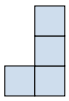

D. 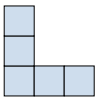

2) Если вы посмотрите на фигуру 3d сзади, то что вы увидите?

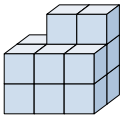

A.

B. 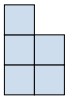

C. 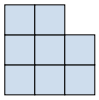

D. 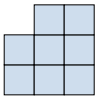

3) Если вы посмотрите на фигуру 3d с правой стороны, то что вы увидите?

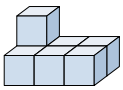

A.

B.

C.

D.

4) Если вы посмотрите на фигуру 3d сверху, то что вы увидите?

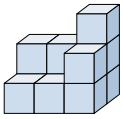

A. 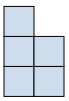

B.

C. 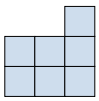

D. 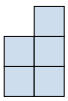

5) Если вы посмотрите на фигуру 3d сзади, то что вы увидите?

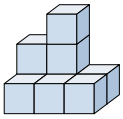

A. 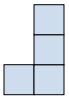

B. 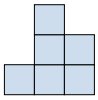

C.

D. 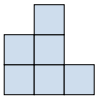

Ответы

1. _____
2. _____
3. _____
4. _____
5. _____

1-5	80	60	40	20	0

Решите каждую задачу.

1) Если вы посмотрите на фигуру 3d с правой стороны, то что вы увидите?

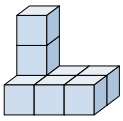

A. 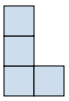

B. 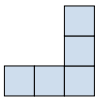

C. 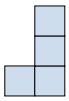

D. 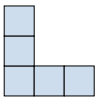

2) Если вы посмотрите на фигуру 3d сзади, то что вы увидите?

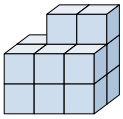

A.

B. 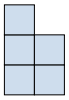

C. 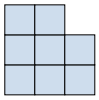

D. 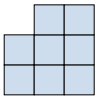

3) Если вы посмотрите на фигуру 3d с правой стороны, то что вы увидите?

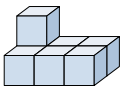

A.

B.

C.

D.

4) Если вы посмотрите на фигуру 3d сверху, то что вы увидите?

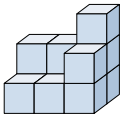

A. 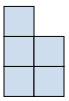

B.

C. 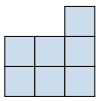

D. 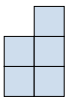

5) Если вы посмотрите на фигуру 3d сзади, то что вы увидите?

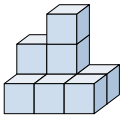

A. 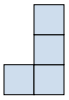

B. 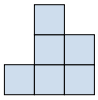

C.

D. 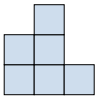

Ответы

1. C
2. C
3. A
4. B
5. B

1-5	80	60	40	20	0

Решите каждую задачу.

Ответы

1. _____
2. _____
3. _____
4. _____
5. _____

1) Если вы посмотрите на фигуру 3d сзади, то что вы увидите?

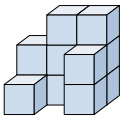

A. 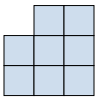

B. 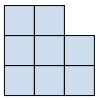

C. 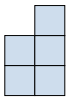

D. 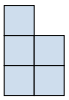

2) Если вы посмотрите на фигуру 3d сзади, то что вы увидите?

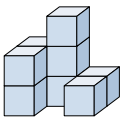

A.

B. 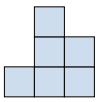

C. 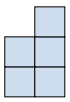

D. 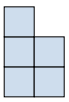

3) Если вы посмотрите на фигуру 3d сзади, то что вы увидите?

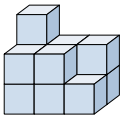

A.

B. 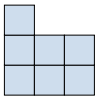

C. 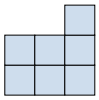

D. 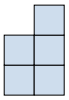

4) Если вы посмотрите на фигуру 3d с левой стороны, то что вы увидите?

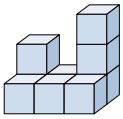

A. 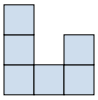

B. 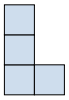

C.

D. 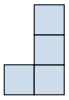

5) Если вы посмотрите на фигуру 3d сзади, то что вы увидите?

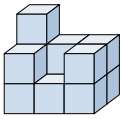

A. 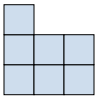

B. 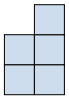

C. 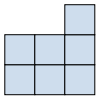

D.

1-5	80	60	40	20	0

Решите каждую задачу.

1) Если вы посмотрите на фигуру 3d сзади, то что вы увидите?

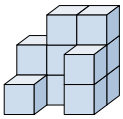

A. 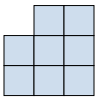

B. 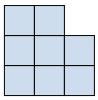

C. 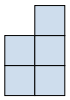

D. 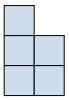

2) Если вы посмотрите на фигуру 3d сзади, то что вы увидите?

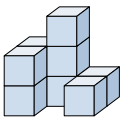

A.

B. 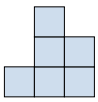

C. 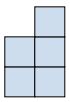

D. 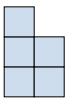

3) Если вы посмотрите на фигуру 3d сзади, то что вы увидите?

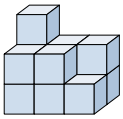

A.

B. 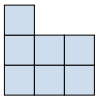

C. 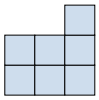

D. 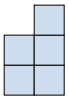

4) Если вы посмотрите на фигуру 3d с левой стороны, то что вы увидите?

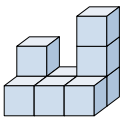

A. 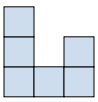

B. 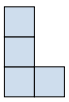

C.

D. 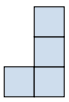

5) Если вы посмотрите на фигуру 3d сзади, то что вы увидите?

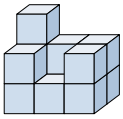

A. 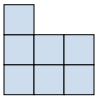

B. 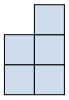

C. 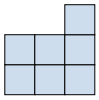

D.

Ответы

1. B
2. B
3. C
4. B
5. C

1-5	80	60	40	20	0

Решите каждую задачу.

1) Если вы посмотрите на фигуру 3d сверху, то что вы увидите?

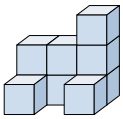

A. 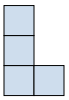

B.

C. 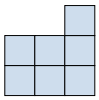

D. 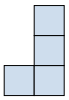

2) Если вы посмотрите на фигуру 3d с левой стороны, то что вы увидите?

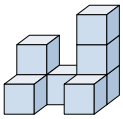

A. 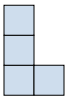

B. 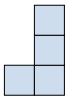

C. 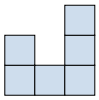

D.

3) Если вы посмотрите на фигуру 3d сверху, то что вы увидите?

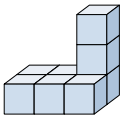

A. 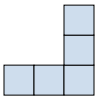

B.

C. 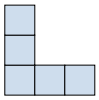

D. 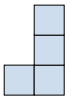

4) Если вы посмотрите на фигуру 3d с левой стороны, то что вы увидите?

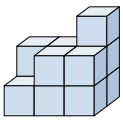

A. 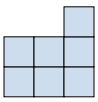

B. 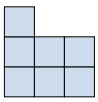

C.

D. 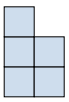

5) Если вы посмотрите на фигуру 3d с правой стороны, то что вы увидите?

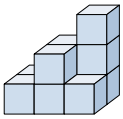

A. 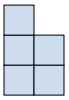

B. 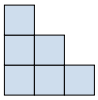

C.

D. 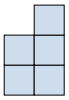

Ответы

1. _____
2. _____
3. _____
4. _____
5. _____

1-5	80	60	40	20	0

Решите каждую задачу.

1) Если вы посмотрите на фигуру 3d сверху, то что вы увидите?

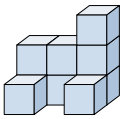

A. 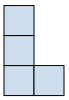

B.

C. 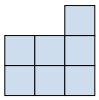

D. 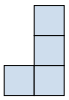

2) Если вы посмотрите на фигуру 3d с левой стороны, то что вы увидите?

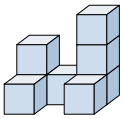

A. 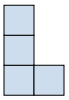

B. 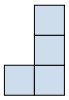

C. 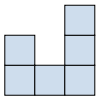

D.

3) Если вы посмотрите на фигуру 3d сверху, то что вы увидите?

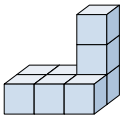

A. 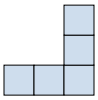

B.

C. 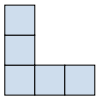

D. 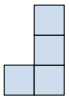

4) Если вы посмотрите на фигуру 3d с левой стороны, то что вы увидите?

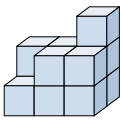

A. 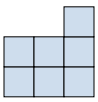

B. 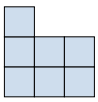

C.

D. 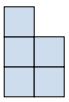

5) Если вы посмотрите на фигуру 3d с правой стороны, то что вы увидите?

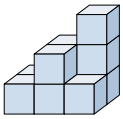

A. 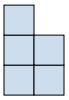

B. 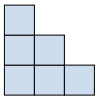

C.

D. 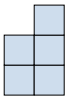

Ответы

1. B
2. A
3. B
4. D
5. D

1-5	80	60	40	20	0

Решите каждую задачу.

1) Если вы посмотрите на фигуру 3d с правой стороны, то что вы увидите?

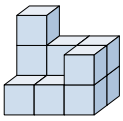

A.

B. 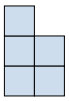

C. 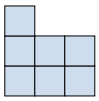

D. 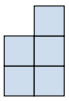

2) Если вы посмотрите на фигуру 3d с левой стороны, то что вы увидите?

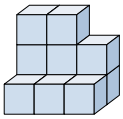

A. 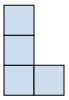

B. 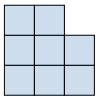

C. 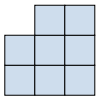

D.

3) Если вы посмотрите на фигуру 3d сверху, то что вы увидите?

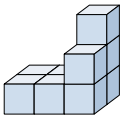

A.

B. 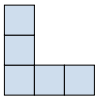

C. 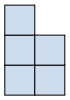

D. 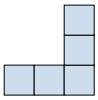

4) Если вы посмотрите на фигуру 3d с левой стороны, то что вы увидите?

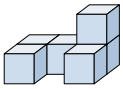

A.

B.

C.

D.

5) Если вы посмотрите на фигуру 3d с правой стороны, то что вы увидите?

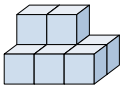

A.

B.

C.

D.

Ответы

1. _____
2. _____
3. _____
4. _____
5. _____

1-5	80	60	40	20	0

Решите каждую задачу.

1) Если вы посмотрите на фигуру 3d с правой стороны, то что вы увидите?

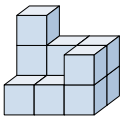

A.

B. 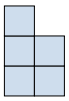

C. 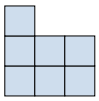

D. 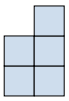

2) Если вы посмотрите на фигуру 3d с левой стороны, то что вы увидите?

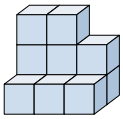

A. 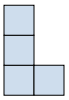

B. 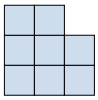

C. 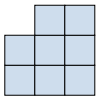

D.

3) Если вы посмотрите на фигуру 3d сверху, то что вы увидите?

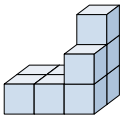

A.

B. 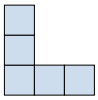

C. 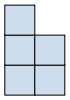

D. 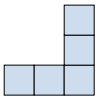

4) Если вы посмотрите на фигуру 3d с левой стороны, то что вы увидите?

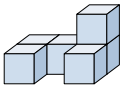

A.

B.

C.

D.

5) Если вы посмотрите на фигуру 3d с правой стороны, то что вы увидите?

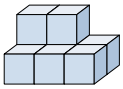

A.

B.

C.

D.

Ответы

1. D
2. A
3. A
4. D
5. B

1-5	80	60	40	20	0

Решите каждую задачу.

1) Если вы посмотрите на фигуру 3d с левой стороны, то что вы увидите?

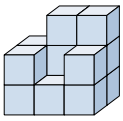

A. 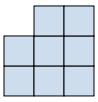

B. 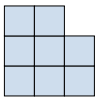

C. 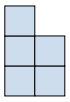

D.

2) Если вы посмотрите на фигуру 3d сверху, то что вы увидите?

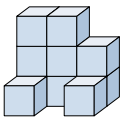

A.

B. 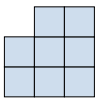

C. 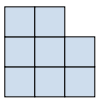

D. 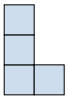

3) Если вы посмотрите на фигуру 3d сзади, то что вы увидите?

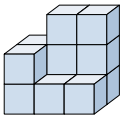

A. 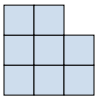

B. 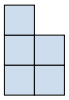

C.

D. 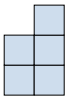

4) Если вы посмотрите на фигуру 3d с левой стороны, то что вы увидите?

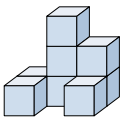

A. 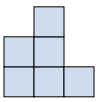

B.

C. 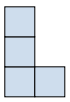

D. 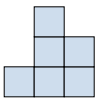

5) Если вы посмотрите на фигуру 3d с левой стороны, то что вы увидите?

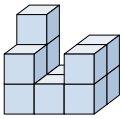

A. 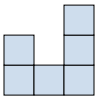

B.

C. 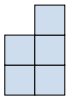

D. 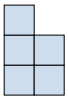

Ответы

1. _____
2. _____
3. _____
4. _____
5. _____

1-5	80	60	40	20	0

Решите каждую задачу.

1) Если вы посмотрите на фигуру 3d с левой стороны, то что вы увидите?

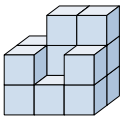

A. 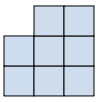

B. 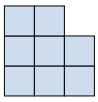

C. 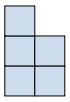

D.

2) Если вы посмотрите на фигуру 3d сверху, то что вы увидите?

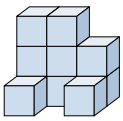

A.

B. 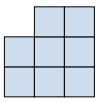

C. 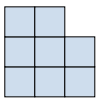

D. 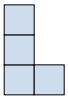

3) Если вы посмотрите на фигуру 3d сзади, то что вы увидите?

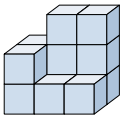

A. 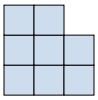

B. 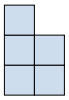

C.

D. 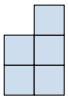

4) Если вы посмотрите на фигуру 3d с левой стороны, то что вы увидите?

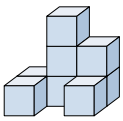

A. 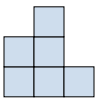

B.

C. 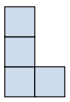

D. 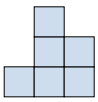

5) Если вы посмотрите на фигуру 3d с левой стороны, то что вы увидите?

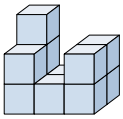

A. 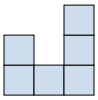

B.

C. 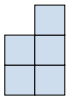

D. 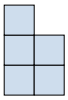

Ответы

1. C
2. A
3. A
4. C
5. D

1-5	80	60	40	20	0

Решите каждую задачу.

1) Если вы посмотрите на фигуру 3d с левой стороны, то что вы увидите?

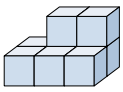

A.

B.

C.

D.

2) Если вы посмотрите на фигуру 3d с правой стороны, то что вы увидите?

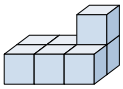

A.

B.

C.

D.

3) Если вы посмотрите на фигуру 3d сзади, то что вы увидите?

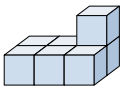

A.

B.

C.

D.

4) Если вы посмотрите на фигуру 3d сверху, то что вы увидите?

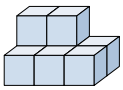

A.

B.

C.

D.

5) Если вы посмотрите на фигуру 3d сверху, то что вы увидите?

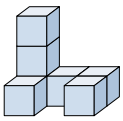

A. 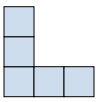

B. 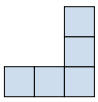

C. 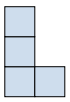

D.

Ответы

1. _____
2. _____
3. _____
4. _____
5. _____

1-5	80	60	40	20	0

Решите каждую задачу.

1) Если вы посмотрите на фигуру 3d с левой стороны, то что вы увидите?

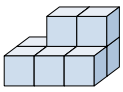

A.

B.

C.

D.

2) Если вы посмотрите на фигуру 3d с правой стороны, то что вы увидите?

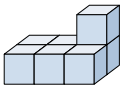

A.

B.

C.

D.

3) Если вы посмотрите на фигуру 3d сзади, то что вы увидите?

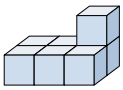

A.

B.

C.

D.

4) Если вы посмотрите на фигуру 3d сверху, то что вы увидите?

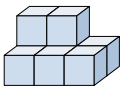

A.

B.

C.

D.

5) Если вы посмотрите на фигуру 3d сверху, то что вы увидите?

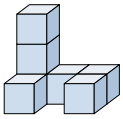

A. 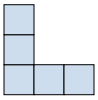

B. 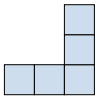

C. 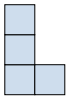

D.

Ответы

1. A
2. D
3. D
4. B
5. D

1-5	80	60	40	20	0

Решите каждую задачу.

Ответы

1. _____
2. _____
3. _____
4. _____
5. _____

1) Если вы посмотрите на фигуру 3d с правой стороны, то что вы увидите?

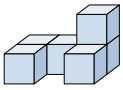

A.

B.

C.

D.

2) Если вы посмотрите на фигуру 3d с правой стороны, то что вы увидите?

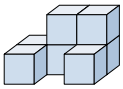

A.

B.

C.

D.

3) Если вы посмотрите на фигуру 3d сзади, то что вы увидите?

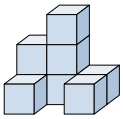

A. 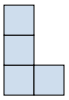

B.

C. 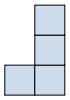

D. 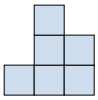

4) Если вы посмотрите на фигуру 3d сверху, то что вы увидите?

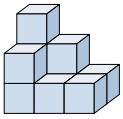

A. 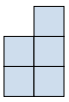

B.

C. 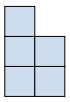

D. 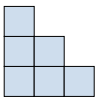

5) Если вы посмотрите на фигуру 3d с правой стороны, то что вы увидите?

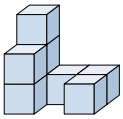

A. 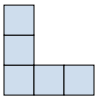

B. 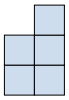

C. 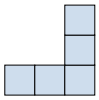

D. 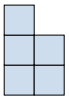

1-5	80	60	40	20	0

Решите каждую задачу.

1) Если вы посмотрите на фигуру 3d с правой стороны, то что вы увидите?

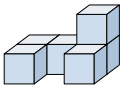

A.

B.

C.

D.

2) Если вы посмотрите на фигуру 3d с правой стороны, то что вы увидите?

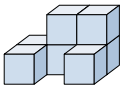

A.

B.

C.

D.

3) Если вы посмотрите на фигуру 3d сзади, то что вы увидите?

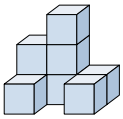

A. 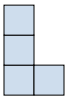

B.

C. 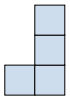

D. 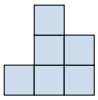

4) Если вы посмотрите на фигуру 3d сверху, то что вы увидите?

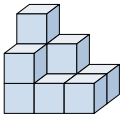

A. 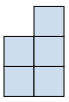

B.

C. 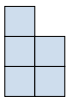

D. 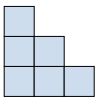

5) Если вы посмотрите на фигуру 3d с правой стороны, то что вы увидите?

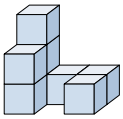

A. 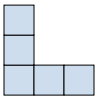

B. 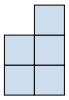

C. 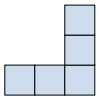

D. 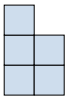

Ответы

1. A
2. C
3. D
4. B
5. B

1-5	80	60	40	20	0

Решите каждую задачу.

1) Если вы посмотрите на фигуру 3d с правой стороны, то что вы увидите?

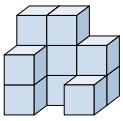

A. 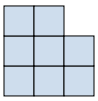

B. 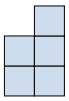

C. 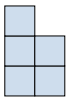

D. 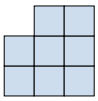

2) Если вы посмотрите на фигуру 3d с правой стороны, то что вы увидите?

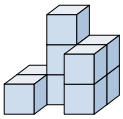

A. 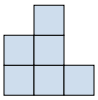

B. 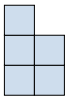

C. 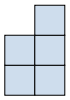

D.

3) Если вы посмотрите на фигуру 3d сверху, то что вы увидите?

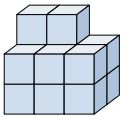

A. 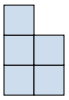

B.

C. 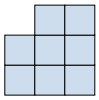

D. 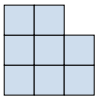

4) Если вы посмотрите на фигуру 3d с левой стороны, то что вы увидите?

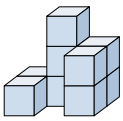

A. 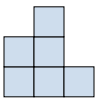

B. 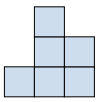

C. 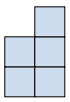

D. 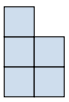

5) Если вы посмотрите на фигуру 3d с левой стороны, то что вы увидите?

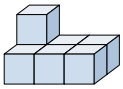

A.

B.

C.

D.

Ответы

1. _____
2. _____
3. _____
4. _____
5. _____

1-5	80	60	40	20	0

Решите каждую задачу.

1) Если вы посмотрите на фигуру 3d с правой стороны, то что вы увидите?

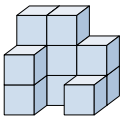

A. 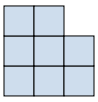

B. 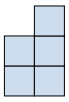

C. 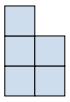

D. 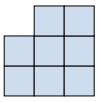

2) Если вы посмотрите на фигуру 3d с правой стороны, то что вы увидите?

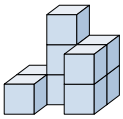

A. 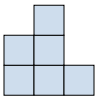

B. 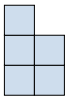

C. 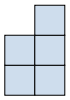

D.

3) Если вы посмотрите на фигуру 3d сверху, то что вы увидите?

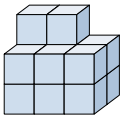

A. 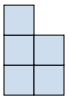

B.

C. 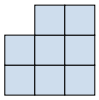

D. 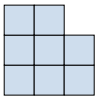

4) Если вы посмотрите на фигуру 3d с левой стороны, то что вы увидите?

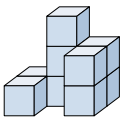

A. 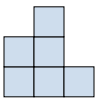

B. 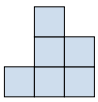

C. 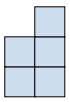

D. 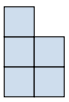

5) Если вы посмотрите на фигуру 3d с левой стороны, то что вы увидите?

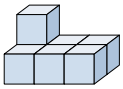

A.

B.

C.

D.

Ответы

1. **B**
2. **C**
3. **B**
4. **D**
5. **B**

1-5	80	60	40	20	0

Решите каждую задачу.

Ответы

1. _____
2. _____
3. _____
4. _____
5. _____

1) Если вы посмотрите на фигуру 3d с правой стороны, то что вы увидите?

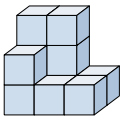

A.

B. 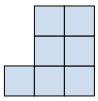

C. 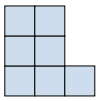

D. 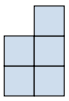

2) Если вы посмотрите на фигуру 3d сзади, то что вы увидите?

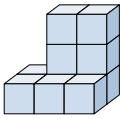

A. 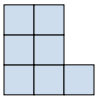

B. 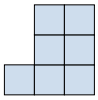

C. 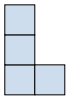

D. 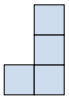

3) Если вы посмотрите на фигуру 3d сзади, то что вы увидите?

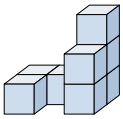

A. 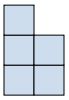

B. 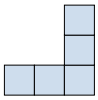

C. 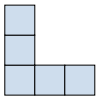

D. 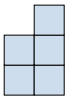

4) Если вы посмотрите на фигуру 3d сзади, то что вы увидите?

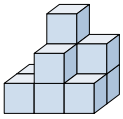

A. 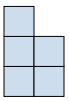

B. 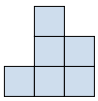

C. 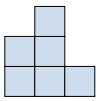

D.

5) Если вы посмотрите на фигуру 3d сверху, то что вы увидите?

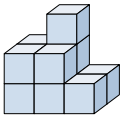

A.

B. 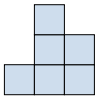

C. 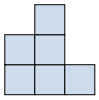

D. 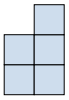

1-5	80	60	40	20	0

Решите каждую задачу.

1) Если вы посмотрите на фигуру 3d с правой стороны, то что вы увидите?

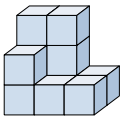

A.

B. 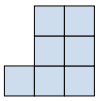

C. 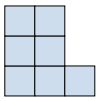

D. 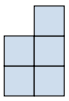

2) Если вы посмотрите на фигуру 3d сзади, то что вы увидите?

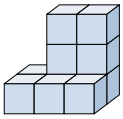

A. 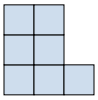

B. 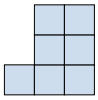

C. 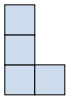

D. 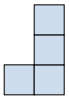

3) Если вы посмотрите на фигуру 3d сзади, то что вы увидите?

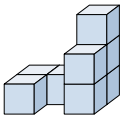

A. 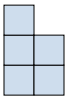

B. 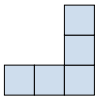

C. 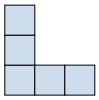

D. 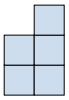

4) Если вы посмотрите на фигуру 3d сзади, то что вы увидите?

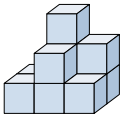

A. 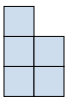

B. 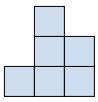

C. 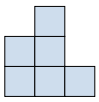

D.

5) Если вы посмотрите на фигуру 3d сверху, то что вы увидите?

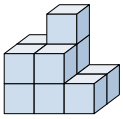

A.

B. 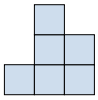

C. 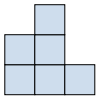

D. 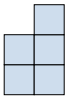

Ответы

1. D
2. A
3. C
4. C
5. A

1-5	80	60	40	20	0