Определение изменения фигуры Имя:

Определите, является ли фигура сдвинутой, повернутой или отраженной.

1) 

2) 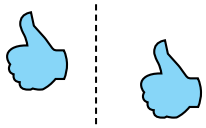

3) 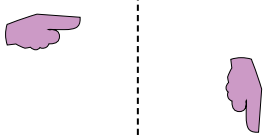

4) 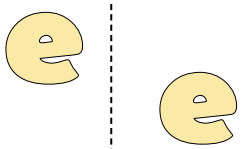

5) 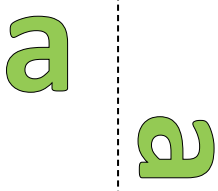

6) 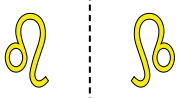

7) 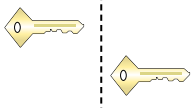

8)

9) 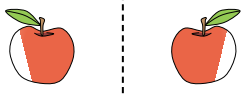

10) 

11) 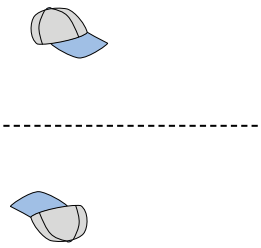

12) 

13) 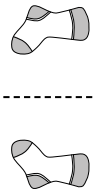

14) 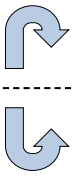

15) 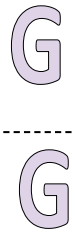

Ответы

1. _____
2. _____
3. _____
4. _____
5. _____
6. _____
7. _____
8. _____
9. _____
10. _____
11. _____
12. _____
13. _____
14. _____
15. _____

1-10	93	87	80	73	67	60	53	47	40	33
11-15	27	20	13	7	0					

Определение изменения фигуры Имя: Ключ к правильным ответам

Определите, является ли фигура сдвинутой, повернутой или отраженной.

1) 

2) 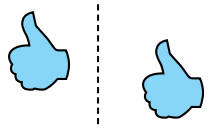

3) 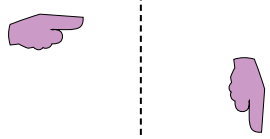

4) 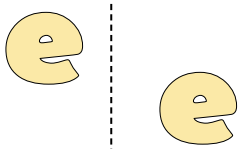

5) 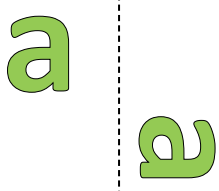

6)

7) 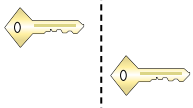

8)

9) 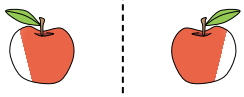

10) 

11) 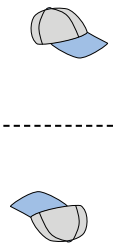

12) 

13) 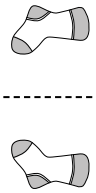

14) 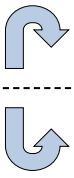

15) 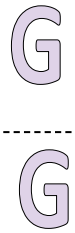

Ответы

1. повернутая
2. сдвинутая
3. повернутая
4. сдвинутая
5. повернутая
6. отраженная
7. сдвинутая
8. отраженная
9. отраженная
10. сдвинутая
11. повернутая
12. отраженная
13. отраженная
14. отраженная
15. сдвинутая

1-10	93	87	80	73	67	60	53	47	40	33
11-15	27	20	13	7	0					