Определение изменения фигуры Имя:

Определите, является ли фигура сдвинутой, повернутой или отраженной.

1)

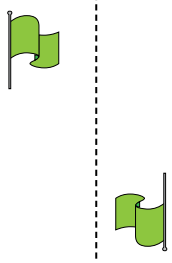

2)

3)

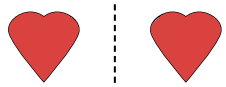

4)

5)



6)

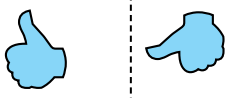

7)



8)

9)

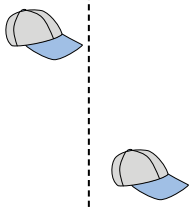

10)

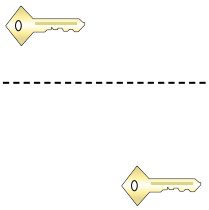

11)



12)

13)

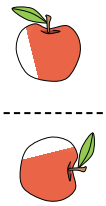

14)



15)



Ответы

1. _____
2. _____
3. _____
4. _____
5. _____
6. _____
7. _____
8. _____
9. _____
10. _____
11. _____
12. _____
13. _____
14. _____
15. _____

1-10	93	87	80	73	67	60	53	47	40	33
11-15	27	20	13	7	0					

Определение изменения фигуры

Имя:

Ключ к правильным ответам

Определите, является ли фигура сдвинутой, повернутой или отраженной.

1)

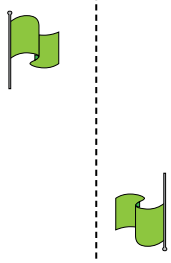

2)

3)

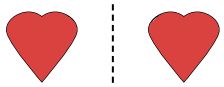

4)

5)

6)

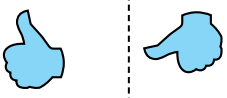

7)



8)

9)

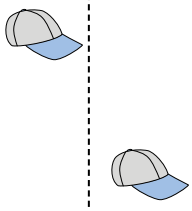

10)

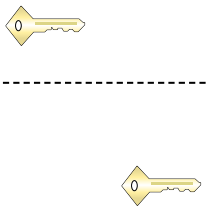

11)



12)

13)

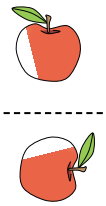

14)



15)



Ответы

1. повернутая
2. отраженная
3. отраженная
4. отраженная
5. сдвинутая
6. повернутая
7. сдвинутая
8. отраженная
9. сдвинутая
10. сдвинутая
11. отраженная
12. повернутая
13. повернутая
14. сдвинутая
15. повернутая

1-10	93	87	80	73	67	60	53	47	40	33
11-15	27	20	13	7	0					