Определение правильных фигур Имя:

**Определите тип данных фигур.**

**1)**

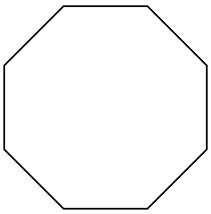

**2)**

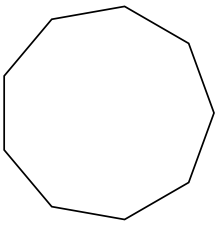

**3)**

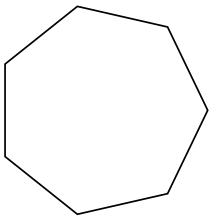

**4)**

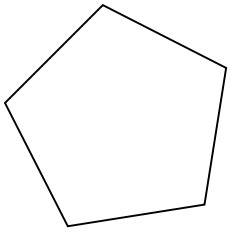

**5)**



**6)**

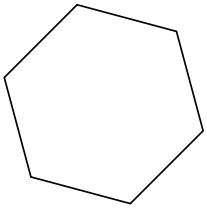

**7)**

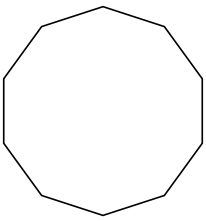

**8)**

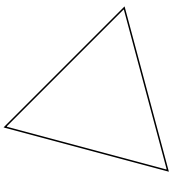

**Ответы**

1. _____
2. _____
3. _____
4. _____
5. _____
6. _____
7. _____
8. _____

| | | | | | | | | |
|---|---|---|---|---|---|---|---|---|
| 1-8 | 88 | 75 | 63 | 50 | 38 | 25 | 13 | 0 |

Определение правильных фигур

Имя: Ключ к правильным ответам

**Определите тип данных фигур.**

**1)**

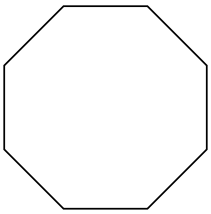

**2)**

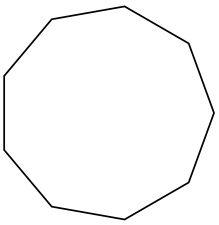

**3)**

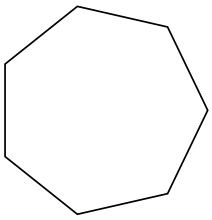

**4)**

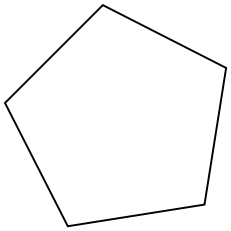

**5)**



**6)**

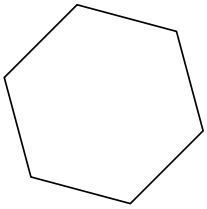

**7)**

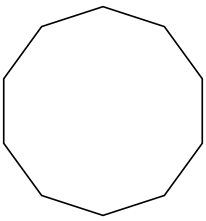

**8)**

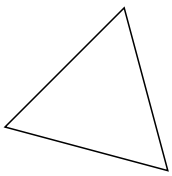

## Ответы

1. восьмиугольник
2. девятиугольник
3. семиугольник
4. пятиугольник
5. четырехугольник
6. шестиугольник
7. десятиугольник
8. треугольник



| | | | | | | | | |
|---|---|---|---|---|---|---|---|---|
| 1-8 | 88 | 75 | 63 | 50 | 38 | 25 | 13 | 0 |