Определение правильных фигур Имя:

Определите тип данных фигур.

1)

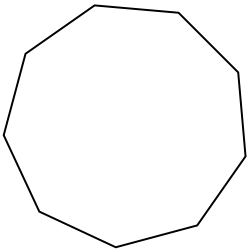

2)

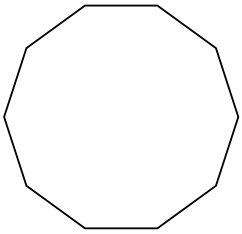

3)



4)

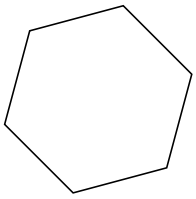

5)

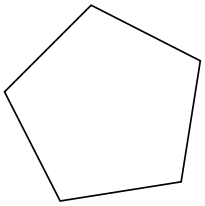

6)

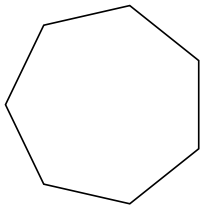

7)

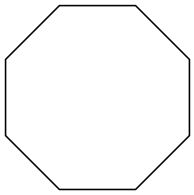

8)



Ответы

1. _____
2. _____
3. _____
4. _____
5. _____
6. _____
7. _____
8. _____

1-8	88	75	63	50	38	25	13	0

Определите тип данных фигур.

1)

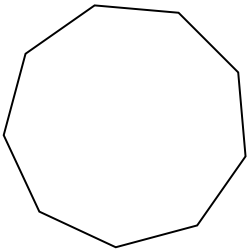

2)

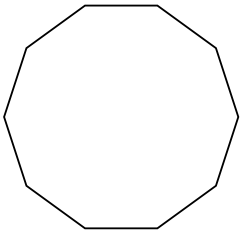

3)



4)

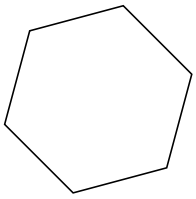

5)

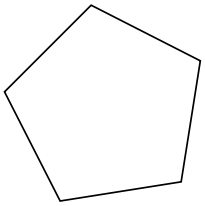

6)

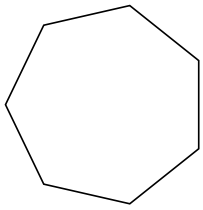

7)

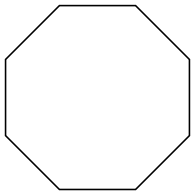

8)



Ответы

1. **девятиугольник**
2. **десятиугольник**
3. **треугольник**
4. **шестиугольник**
5. **пятиугольник**
6. **семиугольник**
7. **восьмиугольник**
8. **четырехугольник**

1-8	88	75	63	50	38	25	13	0