Определение правильных фигур Имя:

Определите тип данных фигур.

1)

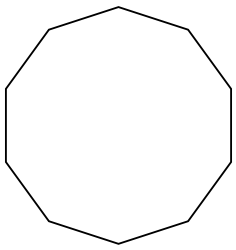

2)

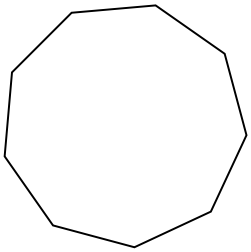

3)

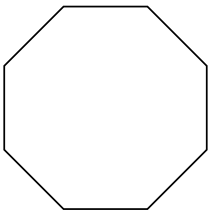

4)

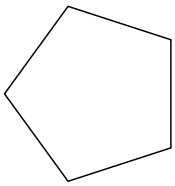

5)

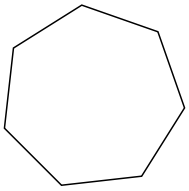

6)

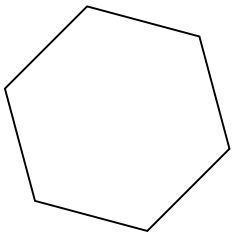

7)



8)



Ответы

1. _____
2. _____
3. _____
4. _____
5. _____
6. _____
7. _____
8. _____

1-8	88	75	63	50	38	25	13	0

Определите тип данных фигур.

1)

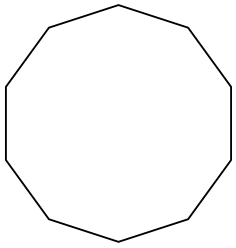

2)

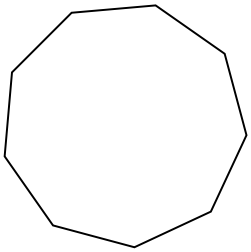

3)

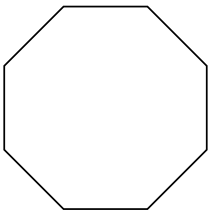

4)

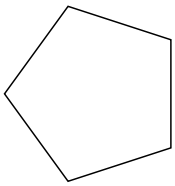

5)

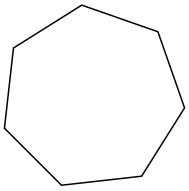

6)

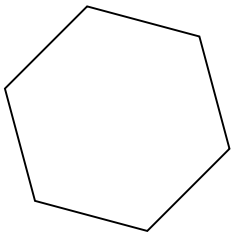

7)



8)



Ответы

1. десятиугольник
2. девятиугольник
3. восьмиугольник
4. пятиугольник
5. семиугольник
6. шестиугольник
7. треугольник
8. четырехугольник

1-8	88	75	63	50	38	25	13	0