Определение неправильных фигур Имя:

Определите тип данных фигур.

1)

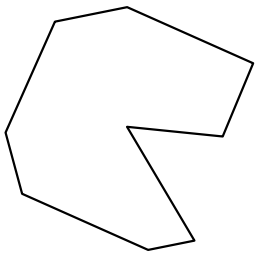

2)

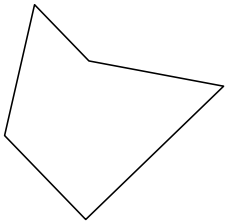

3)



4)

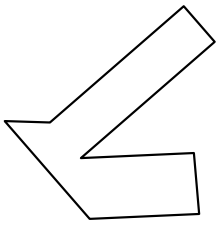

5)

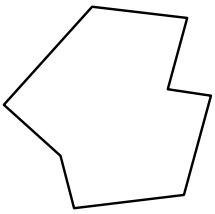

6)

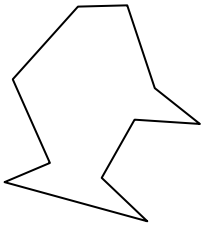

7)

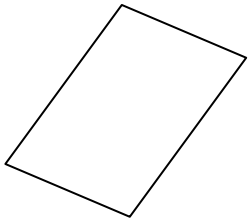

8)

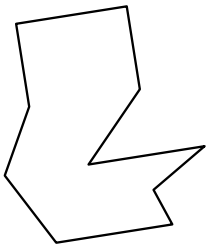

9)

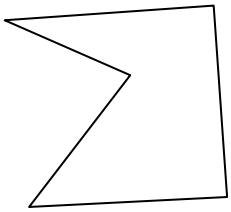

10)

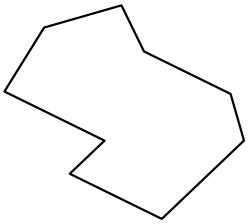

11)

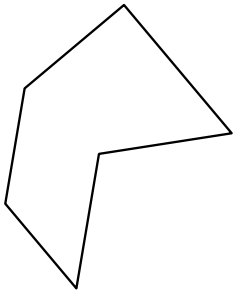

12)

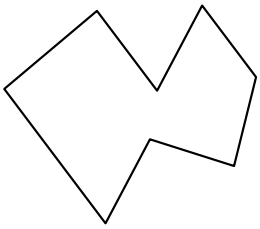

13)

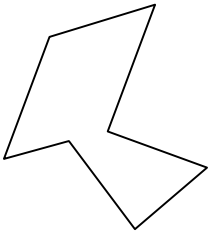

14)

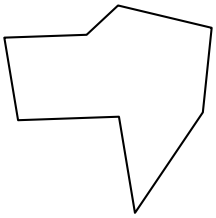

15)

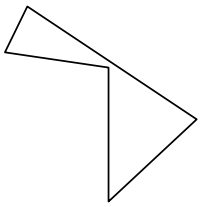

16)



17)

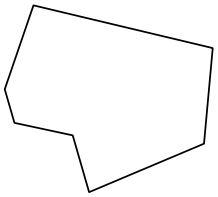

18)



Ответы

1. _____
2. _____
3. _____
4. _____
5. _____
6. _____
7. _____
8. _____
9. _____
10. _____
11. _____
12. _____
13. _____
14. _____
15. _____
16. _____
17. _____
18. _____
19. _____
20. _____
21.

1-10	93	87	80	73	67	60	53	47	40	33
11-15	27	20	13	7	0					

Определение неправильных фигур

Имя: **Ключ к правильным ответам**

Определите тип данных фигур.

1)

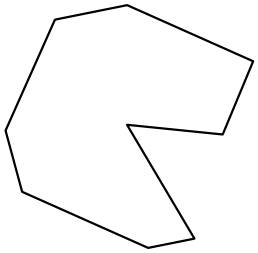

2)

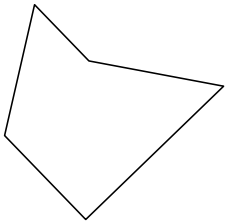

3)



4)

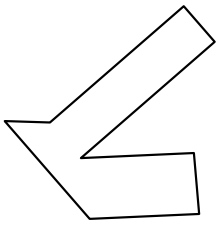

5)

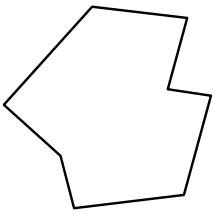

6)

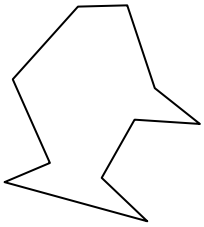

7)

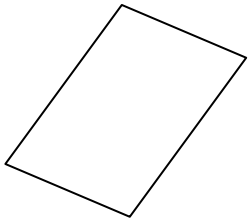

8)

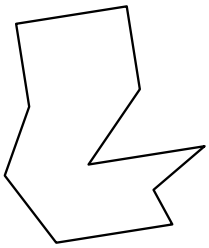

9)

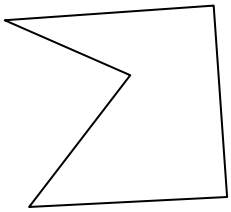

10)

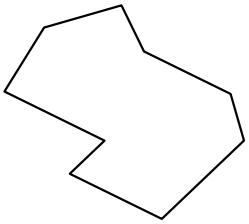

11)

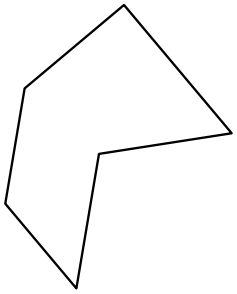

12)

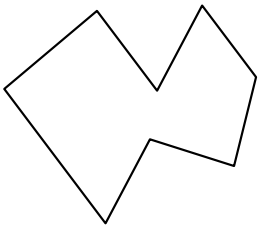

13)

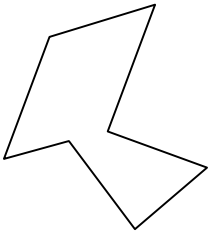

14)

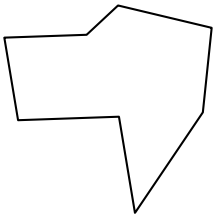

15)

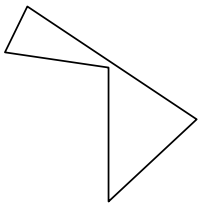

16)



17)

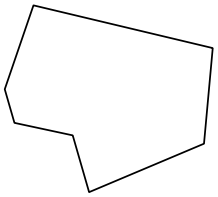

18)



Ответы

1. **девятиугольник**
2. **пятиугольник**
3. **десятиугольник**
4. **восьмиугольник**
5. **восьмиугольник**
6. **десятиугольник**
7. **четырехугольник**
8. **десятиугольник**
9. **пятиугольник**
10. **девятиугольник**
11. **шестиугольник**
12. **восьмиугольник**
13. **семиугольник**
14. **восьмиугольник**
15. **пятиугольник**
16. **семиугольник**
17. **семиугольник**
18. **пятиугольник**
19. **девятиугольник**
20. **девятиугольник**
21. **пятиугольник**

1-10	93	87	80	73	67	60	53	47	40	33
11-15	27	20	13	7	0					

Определение неправильных фигур Имя:

Определите тип данных фигур.

1)



2)

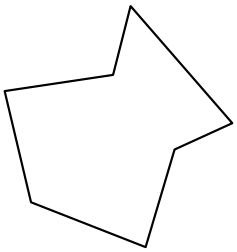

3)

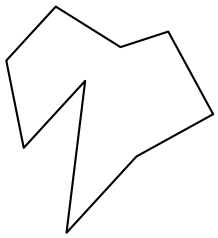

4)

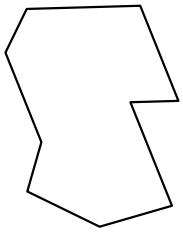

5)

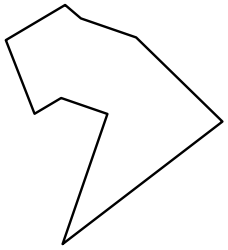

6)

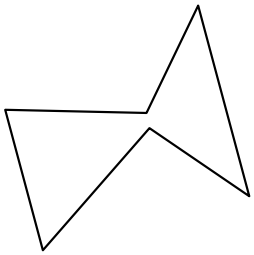

7)

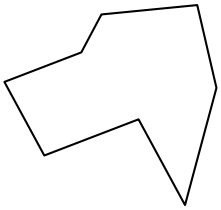

8)

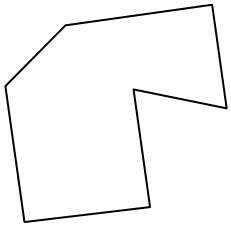

9)



10)



11)

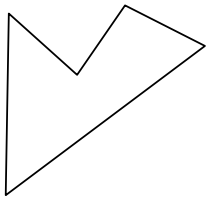

12)

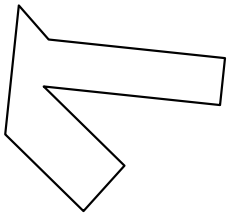

13)

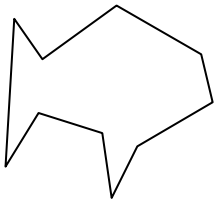

14)

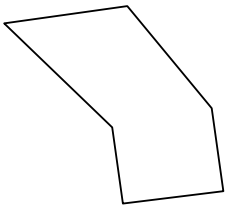

15)

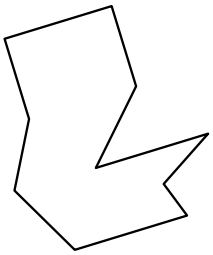

16)

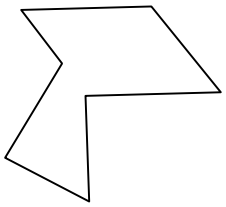

17)

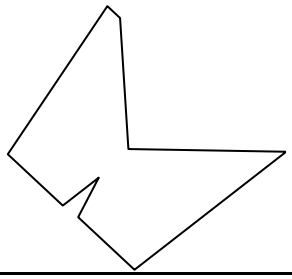

18)

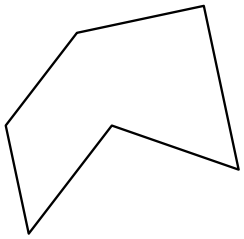

Ответы

1. _____
2. _____
3. _____
4. _____
5. _____
6. _____
7. _____
8. _____
9. _____
10. _____
11. _____
12. _____
13. _____
14. _____
15. _____
16. _____
17. _____
18. _____
19. _____
20. _____
21.

1-10	93	87	80	73	67	60	53	47	40	33
11-15	27	20	13	7	0					

Определение неправильных фигур Имя: **Ключ к правильным ответам**

Определите тип данных фигур.

1)



2)

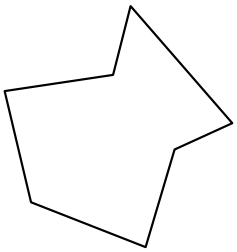

3)

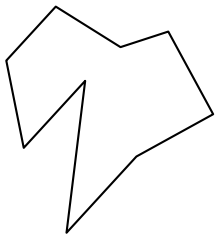

4)

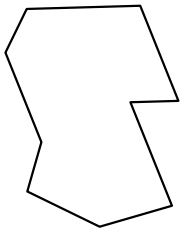

5)

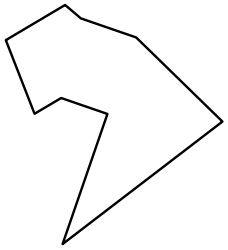

6)

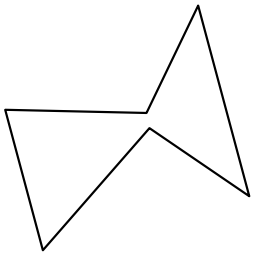

7)

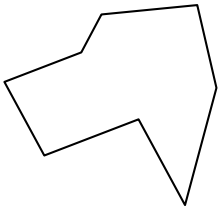

8)

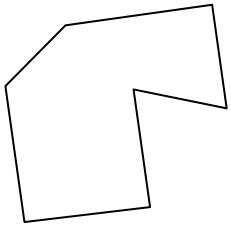

9)



10)



11)

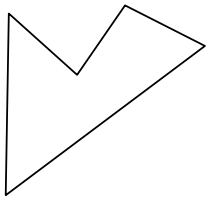

12)

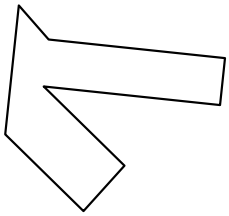

13)

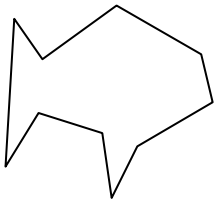

14)

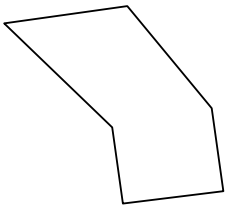

15)

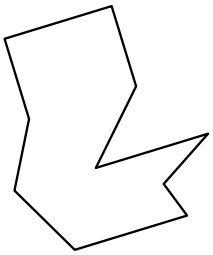

16)

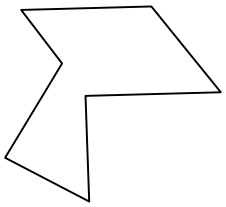

17)

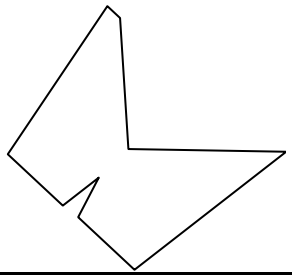

18)

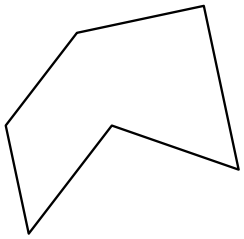

Ответы

1. восьмиугольник
2. семиугольник
3. девятиугольник
4. девятиугольник
5. девятиугольник
6. шестиугольник
7. восьмиугольник
8. семиугольник
9. десятиугольник
10. четырехугольник
11. пятиугольник
12. восьмиугольник
13. десятиугольник
14. шестиугольник
15. десятиугольник
16. семиугольник
17. девятиугольник
18. шестиугольник
19. семиугольник
20. шестиугольник
21. четырехугольник

1-10	93	87	80	73	67	60	53	47	40	33
11-15	27	20	13	7	0					

Определение неправильных фигур Имя:

Определите тип данных фигур.

1)

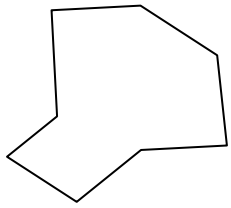

2)

3)

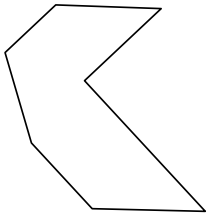

4)



5)

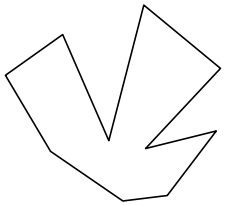

6)

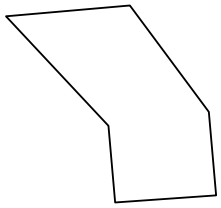

7)

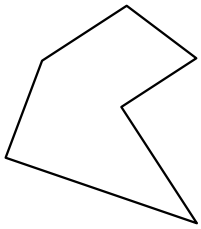

8)



9)

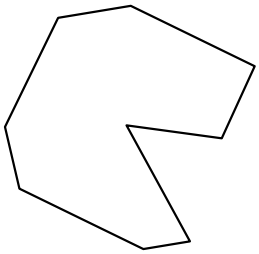

10)

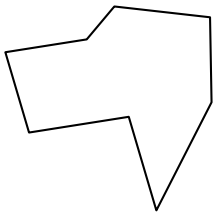

11)

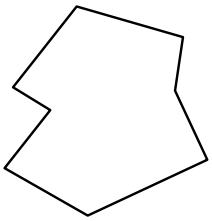

12)

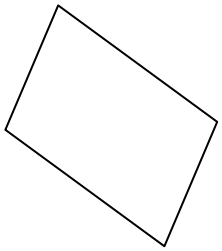

13)

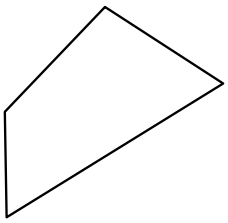

14)

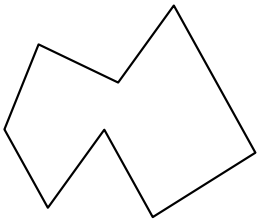

15)



16)

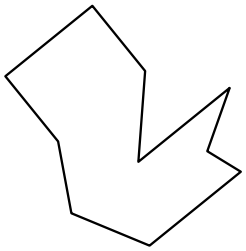

17)



18)

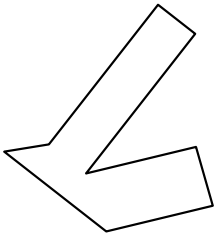

Ответы

1. _____
2. _____
3. _____
4. _____
5. _____
6. _____
7. _____
8. _____
9. _____
10. _____
11. _____
12. _____
13. _____
14. _____
15. _____
16. _____
17. _____
18. _____
19. _____
20. _____
21.

1-10	93	87	80	73	67	60	53	47	40	33
11-15	27	20	13	7	0					

Определение неправильных фигур

Имя: **Ключ к правильным ответам**

Определите тип данных фигур.

1)

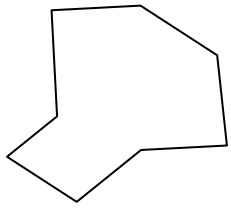

2)

3)

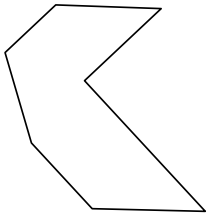

4)



5)

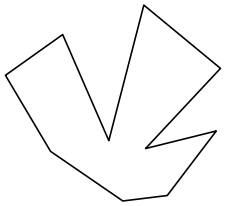

6)

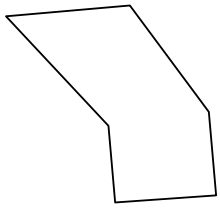

7)

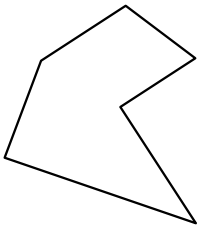

8)



9)

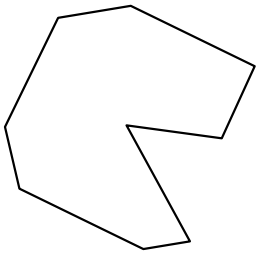

10)

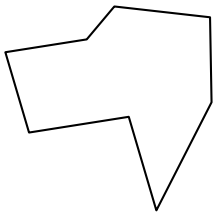

11)

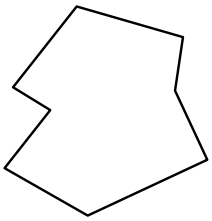

12)

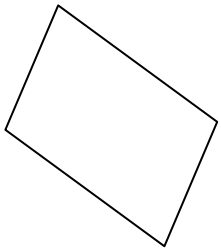

13)

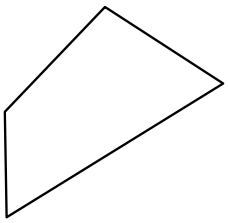

14)

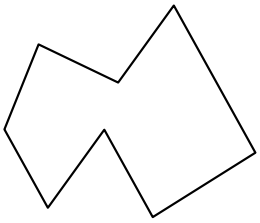

15)



16)

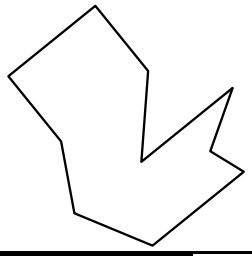

17)



18)

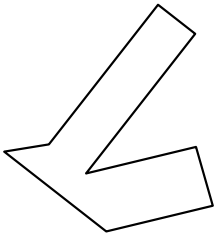

Ответы

1. восьмиугольник
2. четырехугольник
3. семиугольник
4. десятиугольник
5. десятиугольник
6. шестиугольник
7. шестиугольник
8. пятиугольник
9. девятиугольник
10. восьмиугольник
11. восьмиугольник
12. четырехугольник
13. четырехугольник
14. восьмиугольник
15. девятиугольник
16. десятиугольник
17. восьмиугольник
18. восьмиугольник
19. четырехугольник
20. семиугольник
21. девятиугольник

1-10	93	87	80	73	67	60	53	47	40	33
11-15	27	20	13	7	0					

Определение неправильных фигур Имя:

Определите тип данных фигур.

1)

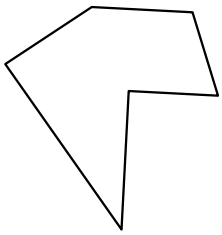

2)

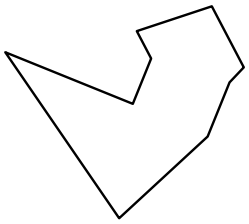

3)

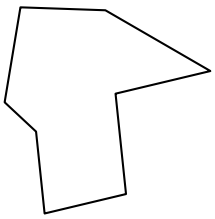

4)

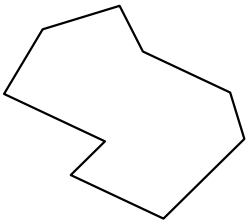

5)

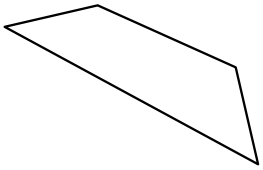

6)

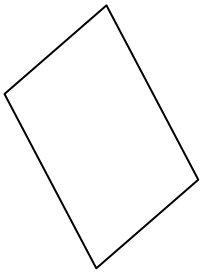

7)

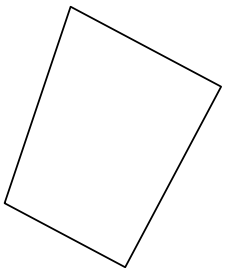

8)

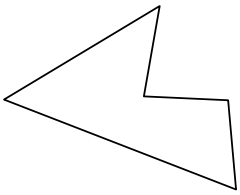

9)



10)

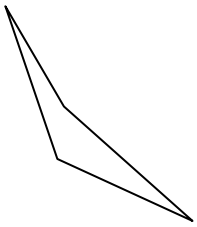

11)

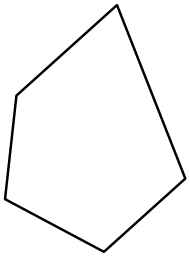

12)

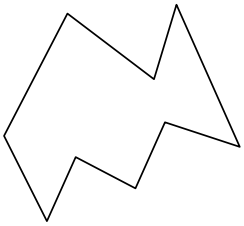

13)

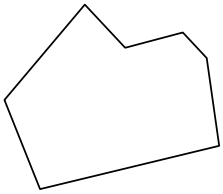

14)

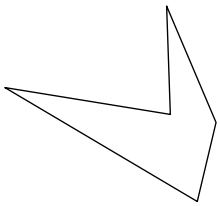

15)

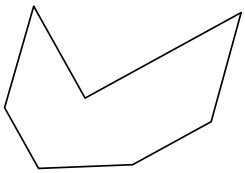

16)



17)

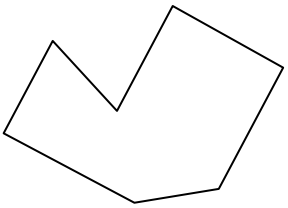

18)

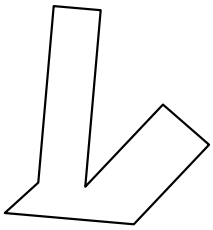

Ответы

1. _____
2. _____
3. _____
4. _____
5. _____
6. _____
7. _____
8. _____
9. _____
10. _____
11. _____
12. _____
13. _____
14. _____
15. _____
16. _____
17. _____
18. _____
19. _____
20. _____
21.

1-10	93	87	80	73	67	60	53	47	40	33
11-15	27	20	13	7	0					

Определение неправильных фигур Имя: Ключ к правильным ответам

Определите тип данных фигур.

1) 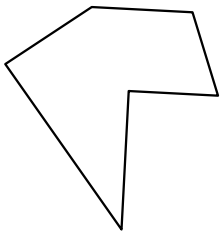

2) 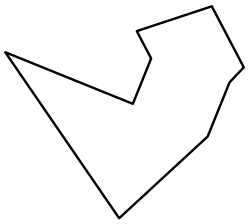

3) 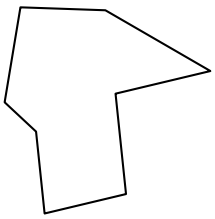

4) 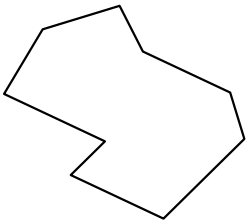

5) 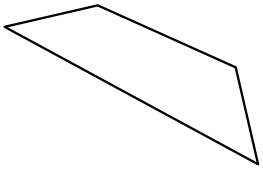

6) 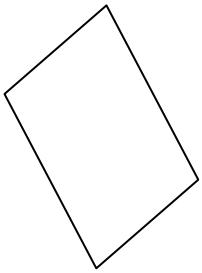

7) 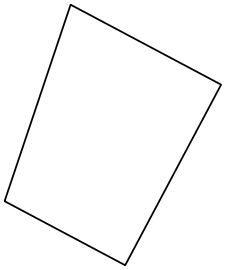

8) 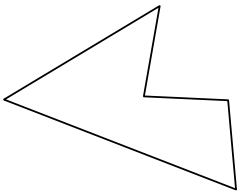

9) 

10) 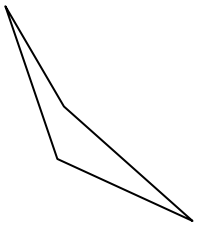

11) 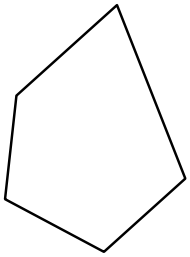

12) 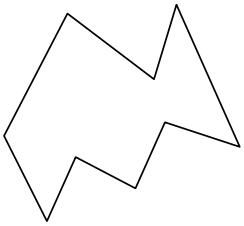

13) 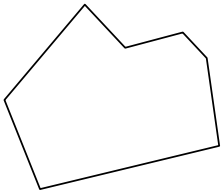

14) 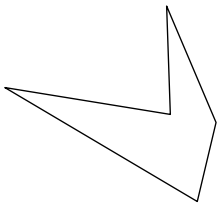

15) 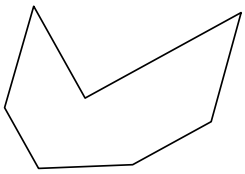

16) 

17) 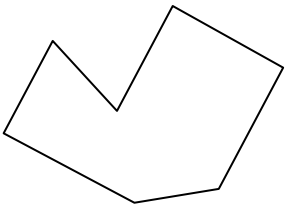

18) 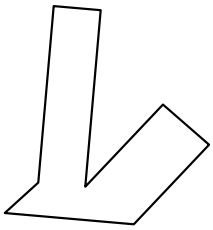

Ответы

1. шестиугольник
2. девятиугольник
3. восьмиугольник
4. девятиугольник
5. четырехугольник
6. четырехугольник
7. четырехугольник
8. пятиугольник
9. семиугольник
10. четырехугольник
11. пятиугольник
12. девятиугольник
13. семиугольник
14. пятиугольник
15. семиугольник
16. шестиугольник
17. семиугольник
18. восьмиугольник
19. восьмиугольник
20. семиугольник
21. восьмиугольник

1-10	93	87	80	73	67	60	53	47	40	33
11-15	27	20	13	7	0					

Определение неправильных фигур Имя:

Определите тип данных фигур.

1)

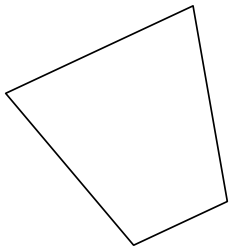

2)

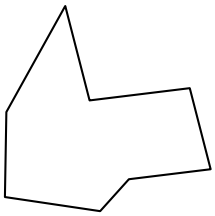

3)



4)

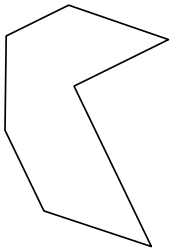

5)

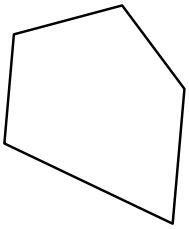

6)

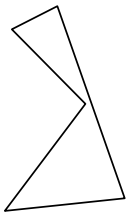

7)

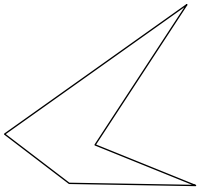

8)



9)

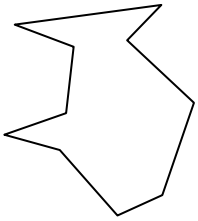

10)

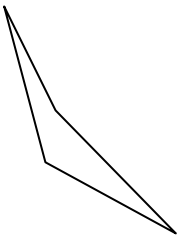

11)

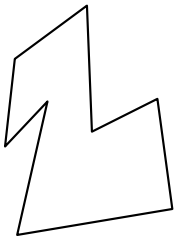

12)

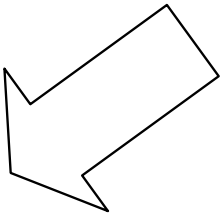

13)

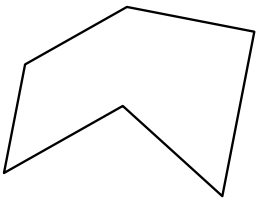

14)

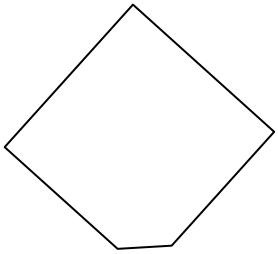

15)

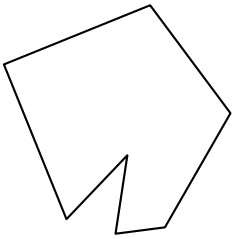

16)

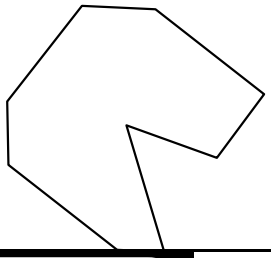

17)

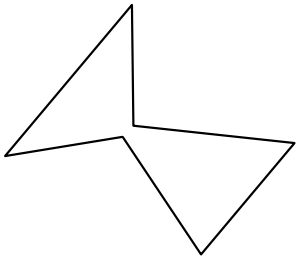

18)

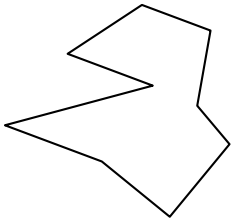

Ответы

1. _____
2. _____
3. _____
4. _____
5. _____
6. _____
7. _____
8. _____
9. _____
10. _____
11. _____
12. _____
13. _____
14. _____
15. _____
16. _____
17. _____
18. _____
19. _____
20. _____
21.

1-10	93	87	80	73	67	60	53	47	40	33
11-15	27	20	13	7	0					

Определение неправильных фигур Имя: Ключ к правильным ответам

Определите тип данных фигур.

1) 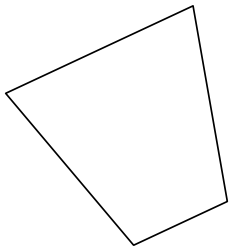

2) 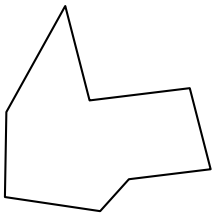

3) 

4) 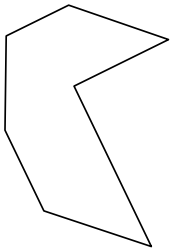

5) 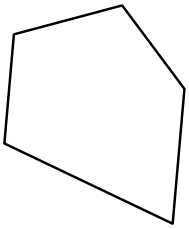

6) 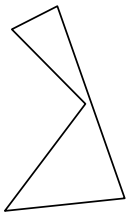

7) 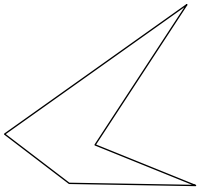

8) 

9) 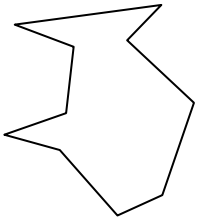

10) 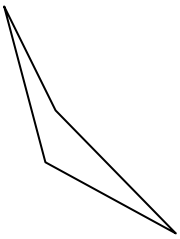

11) 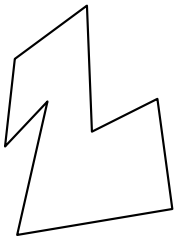

12) 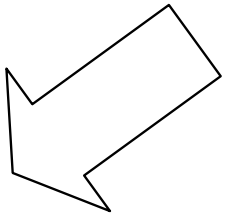

13) 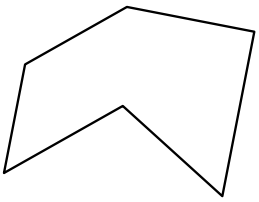

14) 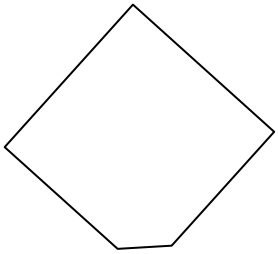

15) 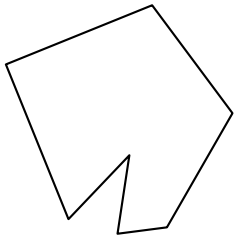

16) 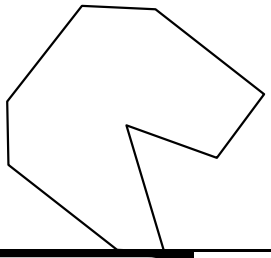

17) 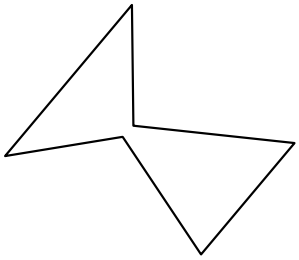

18) 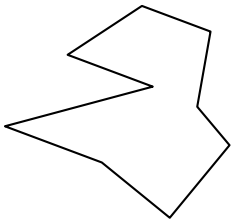

Ответы

1. четырехугольник
2. восьмиугольник
3. пятиугольник
4. семиугольник
5. пятиугольник
6. пятиугольник
7. пятиугольник
8. пятиугольник
9. десятиугольник
10. четырехугольник
11. восьмиугольник
12. семиугольник
13. шестиугольник
14. пятиугольник
15. семиугольник
16. девятиугольник
17. шестиугольник
18. девятиугольник
19. десятиугольник
20. четырехугольник
21. девятиугольник

1-10	93	87	80	73	67	60	53	47	40	33
11-15	27	20	13	7	0					

Определение неправильных фигур Имя:

Определите тип данных фигур.

1) 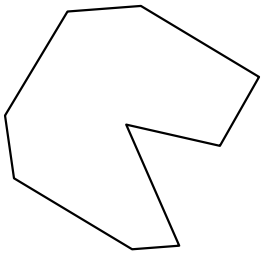

2) 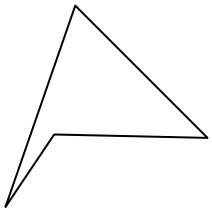

3) 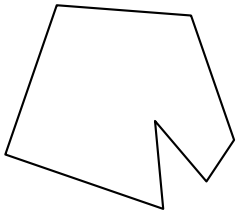

4) 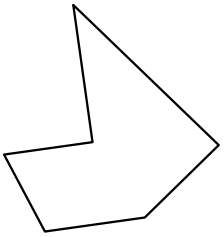

5) 

6) 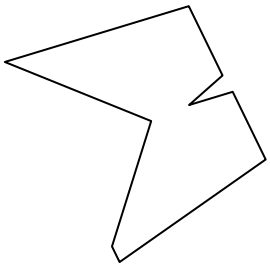

7) 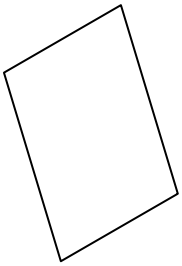

8) 

9) 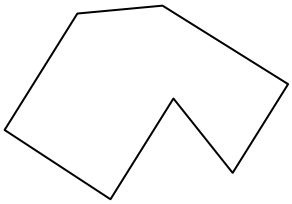

10) 

11) 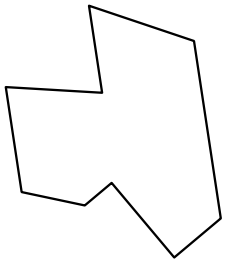

12) 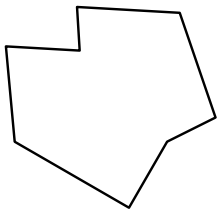

13) 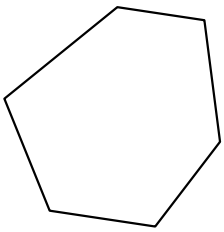

14) 

15) 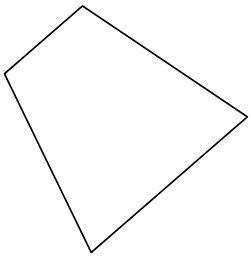

16) 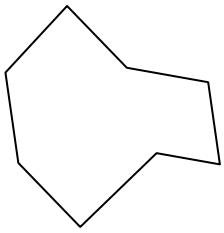

17) 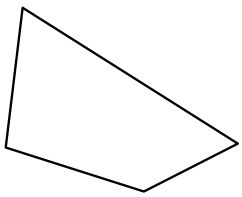

18) 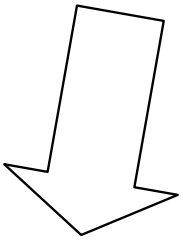

Ответы

1. _____
2. _____
3. _____
4. _____
5. _____
6. _____
7. _____
8. _____
9. _____
10. _____
11. _____
12. _____
13. _____
14. _____
15. _____
16. _____
17. _____
18. _____
19. _____
20. _____
21.

1-10	93	87	80	73	67	60	53	47	40	33
11-15	27	20	13	7	0					

Определение неправильных фигур Имя: Ключ к правильным ответам

Определите тип данных фигур.

1) 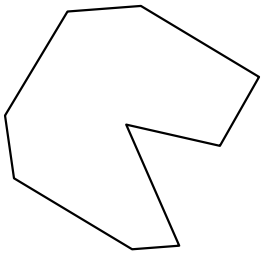

2) 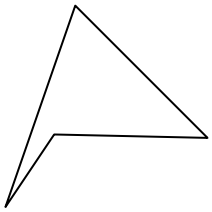

3) 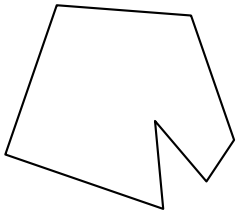

4) 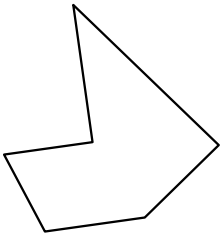

5) 

6) 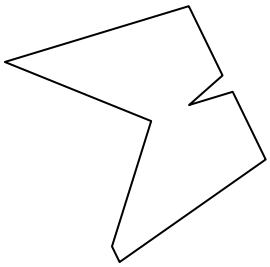

7) 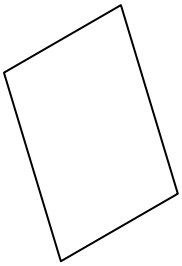

8) 

9) 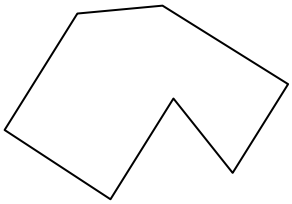

10) 

11) 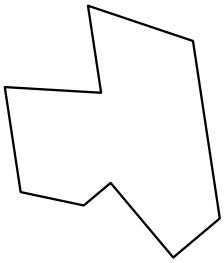

12) 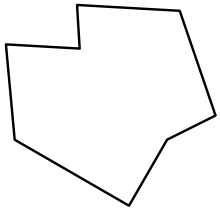

13) 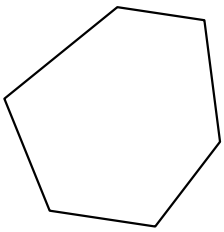

14) 

15) 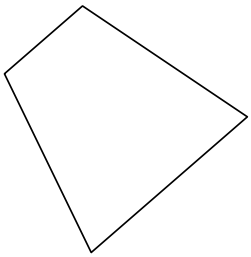

16) 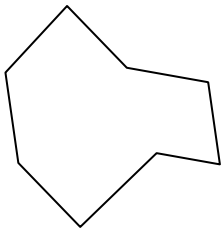

17) 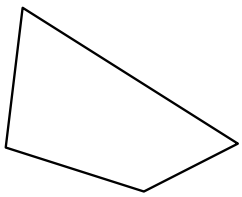

18) 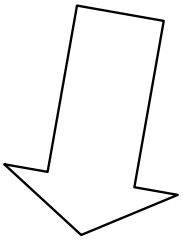

Ответы

1. девятиугольник
2. четырехугольник
3. семиугольник
4. шестиугольник
5. четырехугольник
6. девятиугольник
7. четырехугольник
8. девятиугольник
9. семиугольник
10. десятиугольник
11. девятиугольник
12. восьмиугольник
13. шестиугольник
14. восьмиугольник
15. четырехугольник
16. восьмиугольник
17. четырехугольник
18. семиугольник
19. шестиугольник
20. пятиугольник
21. десятиугольник

1-10	93	87	80	73	67	60	53	47	40	33
11-15	27	20	13	7	0					

Определение неправильных фигур Имя:

Определите тип данных фигур.

1)



2)

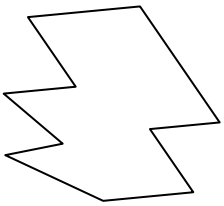

3)

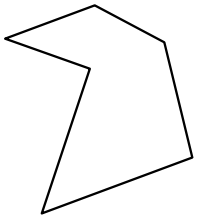

4)

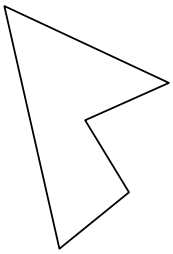

5)

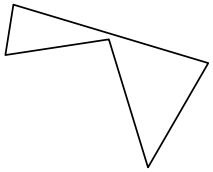

6)

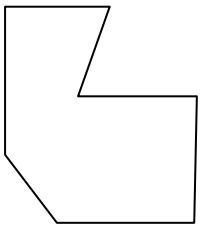

7)



8)

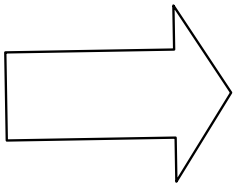

9)

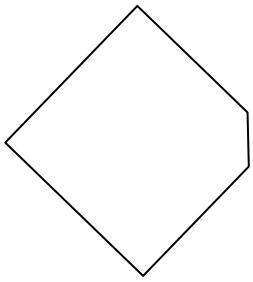

10)

11)

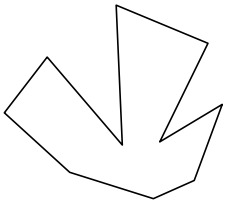

12)

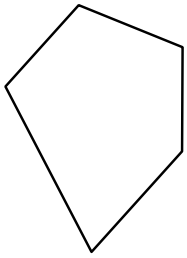

13)

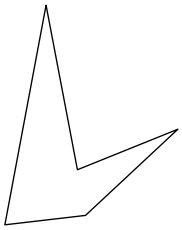

14)

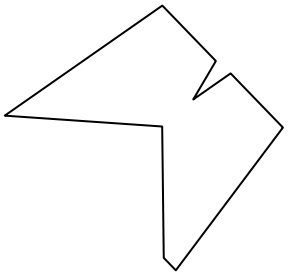

15)



16)

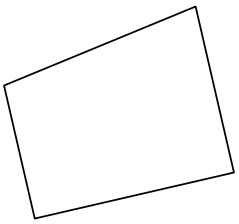

17)

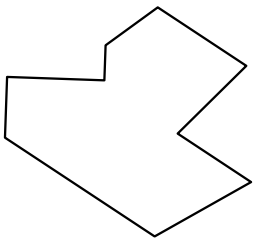

18)

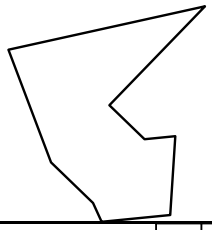

Ответы

1. _____
2. _____
3. _____
4. _____
5. _____
6. _____
7. _____
8. _____
9. _____
10. _____
11. _____
12. _____
13. _____
14. _____
15. _____
16. _____
17. _____
18. _____
19. _____
20. _____
21.

1-10	93	87	80	73	67	60	53	47	40	33
11-15	27	20	13	7	0					

Определение неправильных фигур

Имя: **Ключ к правильным ответам**

Определите тип данных фигур.

1)



2)

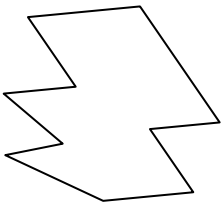

3)

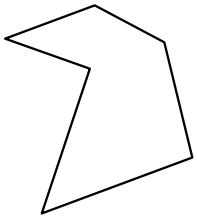

4)

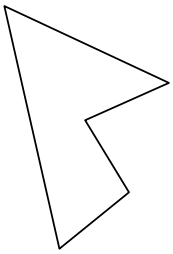

5)

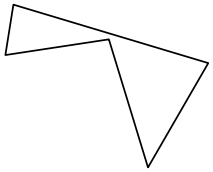

6)

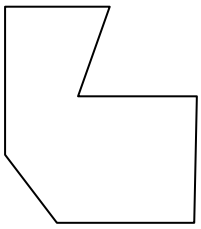

7)



8)

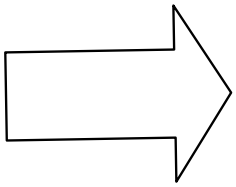

9)

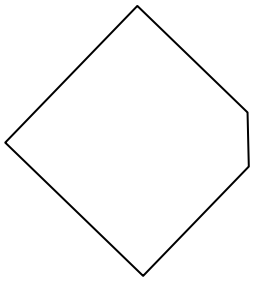

10)

11)

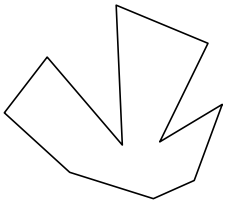

12)

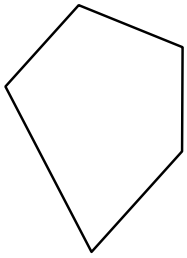

13)

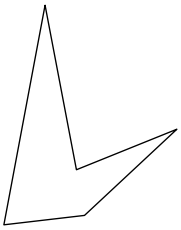

14)

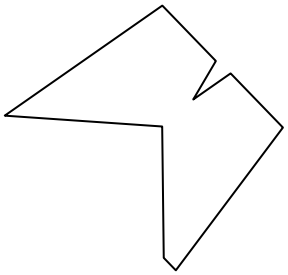

15)



16)

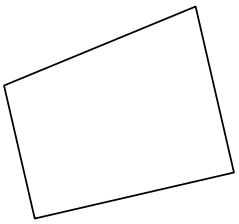

17)

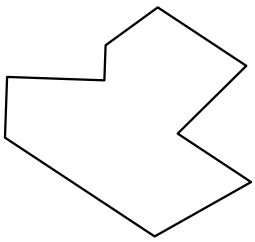

18)

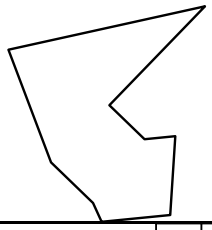

Ответы

1. семиугольник
2. десятиугольник
3. шестиугольник
4. пятиугольник
5. пятиугольник
6. семиугольник
7. девятиугольник
8. семиугольник
9. пятиугольник
10. четырехугольник
11. десятиугольник
12. пятиугольник
13. пятиугольник
14. девятиугольник
15. восьмиугольник
16. четырехугольник
17. девятиугольник
18. девятиугольник
19. восьмиугольник
20. четырехугольник
21. восьмиугольник

1-10	93	87	80	73	67	60	53	47	40	33
11-15	27	20	13	7	0					

Определение неправильных фигур Имя:

Определите тип данных фигур.

1)

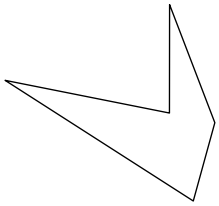

2)

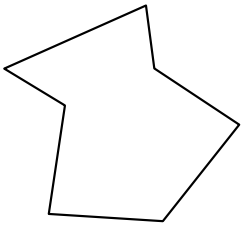

3)

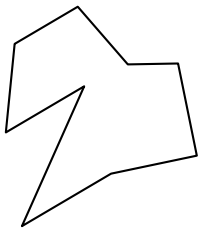

4)

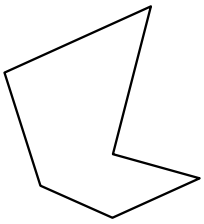

5)



6)

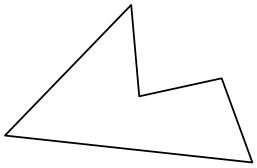

7)

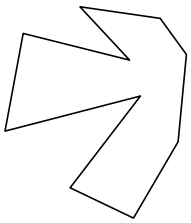

8)

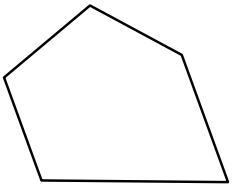

9)

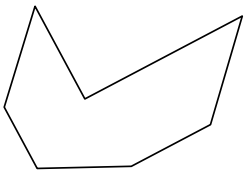

10)

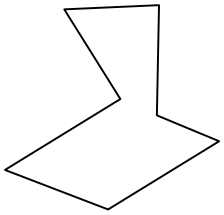

11)



12)

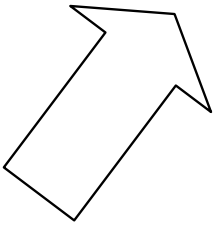

13)

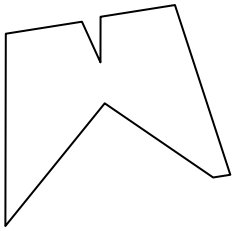

14)

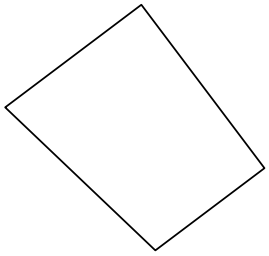

15)

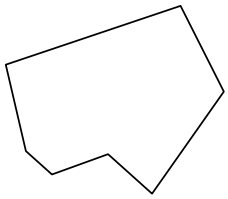

16)

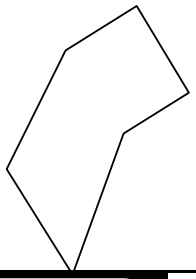

17)

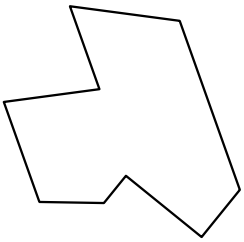

18)

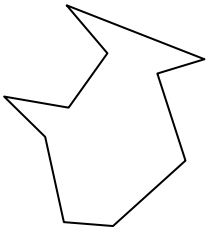

Ответы

1. _____
2. _____
3. _____
4. _____
5. _____
6. _____
7. _____
8. _____
9. _____
10. _____
11. _____
12. _____
13. _____
14. _____
15. _____
16. _____
17. _____
18. _____
19. _____
20. _____
21.

1-10	93	87	80	73	67	60	53	47	40	33
11-15	27	20	13	7	0					

Определение неправильных фигур

Имя: **Ключ к правильным ответам**

Определите тип данных фигур.

1)

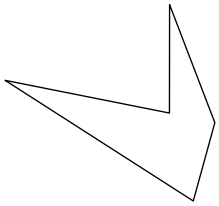

2)

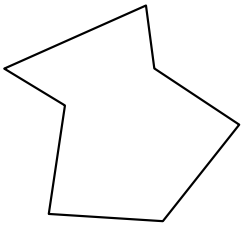

3)

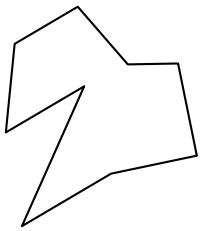

4)

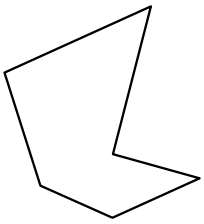

5)



6)

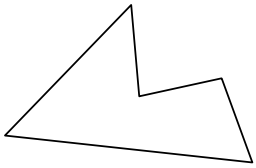

7)

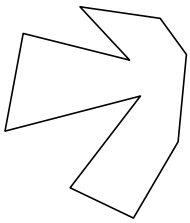

8)

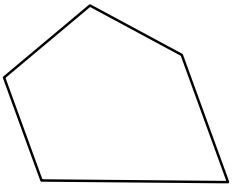

9)

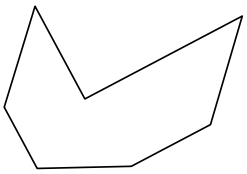

10)

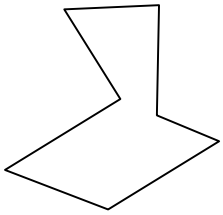

11)



12)

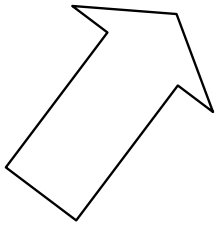

13)

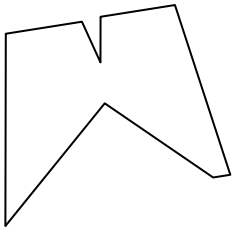

14)

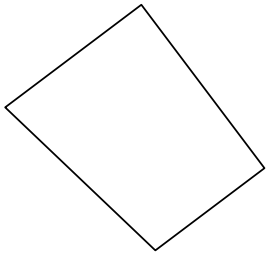

15)

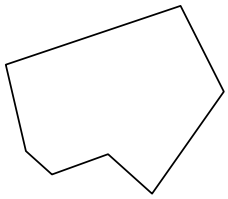

16)

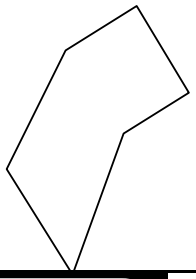

17)

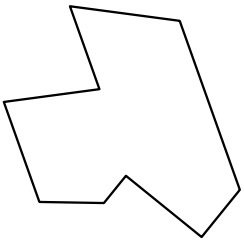

18)

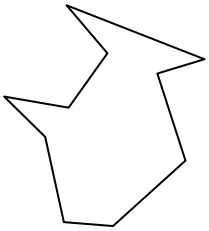

Ответы

1. пятиугольник
2. семиугольник
3. девятиугольник
4. шестиугольник
5. восьмиугольник
6. пятиугольник
7. десятиугольник
8. пятиугольник
9. семиугольник
10. семиугольник
11. пятиугольник
12. семиугольник
13. девятиугольник
14. четырехугольник
15. семиугольник
16. шестиугольник
17. девятиугольник
18. десятиугольник
19. девятиугольник
20. шестиугольник
21. восьмиугольник

1-10	93	87	80	73	67	60	53	47	40	33
11-15	27	20	13	7	0					

Определение неправильных фигур Имя:

Определите тип данных фигур.

1)

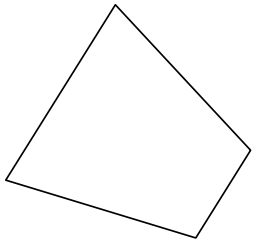

2)

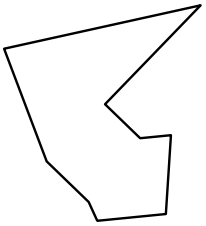

3)

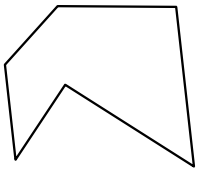

4)



5)



6)

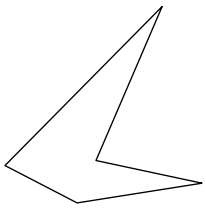

7)

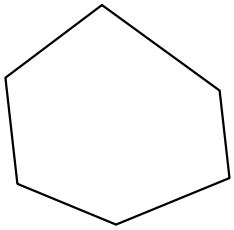

8)

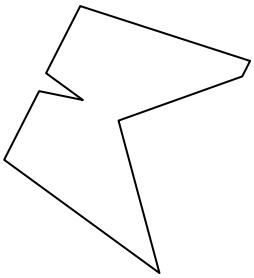

9)

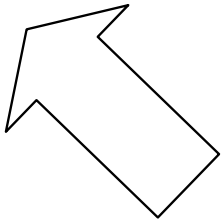

10)

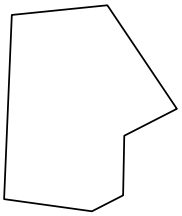

11)

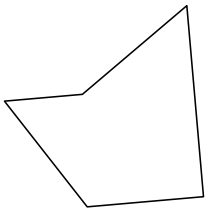

12)

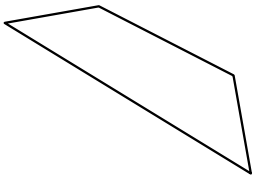

13)

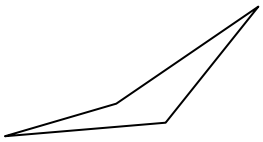

14)

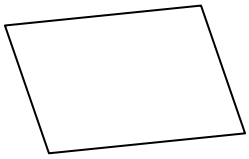

15)



16)

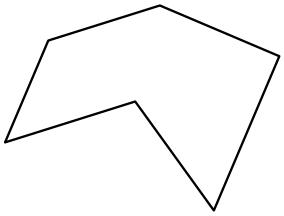

17)

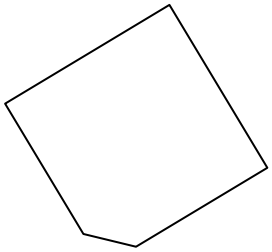

18)

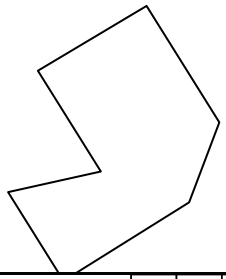

Ответы

1. _____
2. _____
3. _____
4. _____
5. _____
6. _____
7. _____
8. _____
9. _____
10. _____
11. _____
12. _____
13. _____
14. _____
15. _____
16. _____
17. _____
18. _____
19. _____
20. _____
21.

1-10	93	87	80	73	67	60	53	47	40	33
11-15	27	20	13	7	0					

Определение неправильных фигур Имя: Ключ к правильным ответам

Определите тип данных фигур.

1) 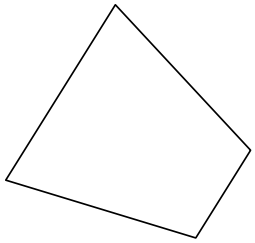

2) 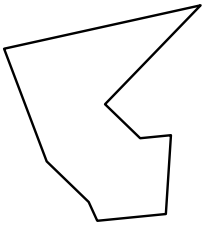

3) 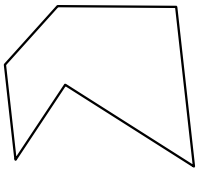

4) 

5) 

6) 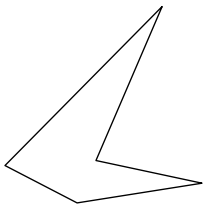

7) 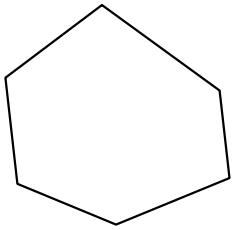

8) 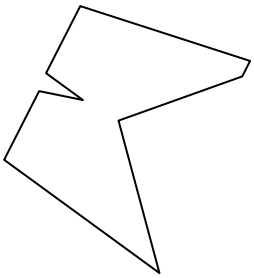

9) 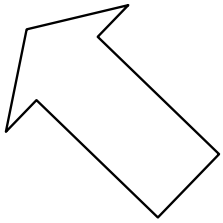

10) 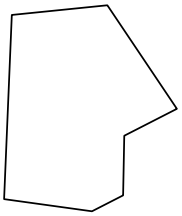

11) 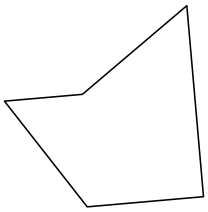

12) 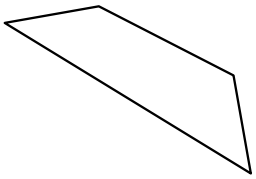

13) 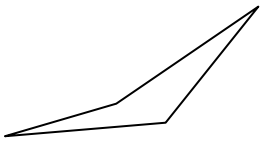

14) 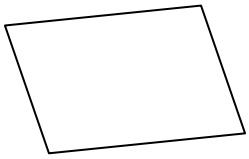

15) 

16) 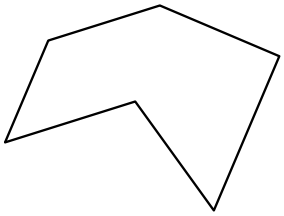

17) 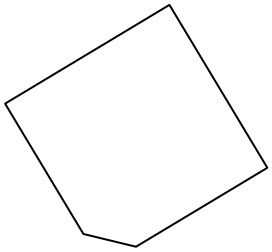

18) 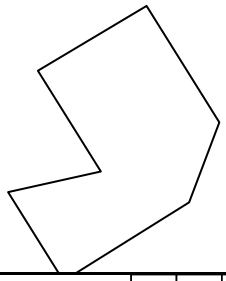

Ответы

1. четырехугольник
2. девятиугольник
3. шестиугольник
4. пятиугольник
5. десятиугольник
6. пятиугольник
7. шестиугольник
8. девятиугольник
9. семиугольник
10. семиугольник
11. пятиугольник
12. четырехугольник
13. четырехугольник
14. четырехугольник
15. семиугольник
16. шестиугольник
17. пятиугольник
18. семиугольник
19. семиугольник
20. восьмиугольник
21. шестиугольник

1-10	93	87	80	73	67	60	53	47	40	33
11-15	27	20	13	7	0					

Определение неправильных фигур Имя:

Определите тип данных фигур.

1)

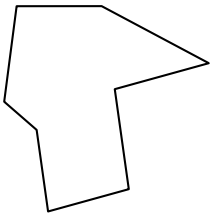

2)

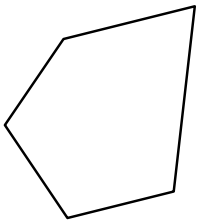

3)



4)

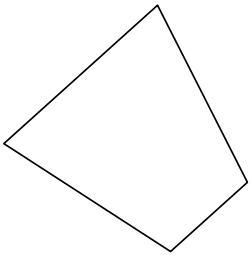

5)

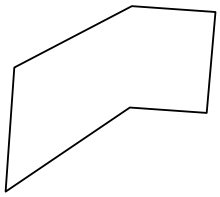

6)

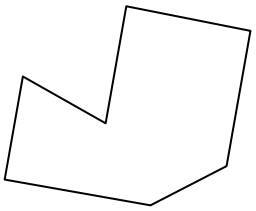

7)

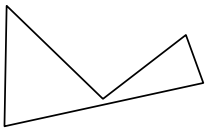

8)



9)

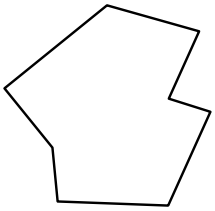

10)

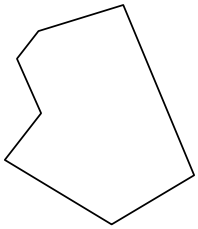

11)

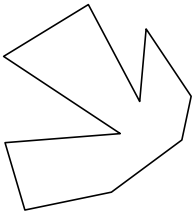

12)

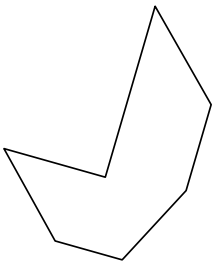

13)

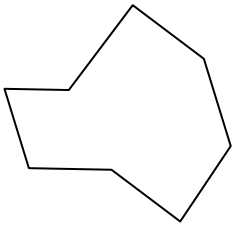

14)

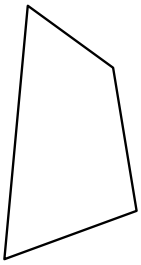

15)

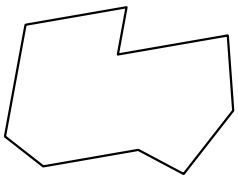

16)

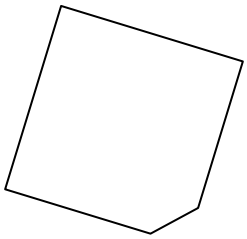

17)

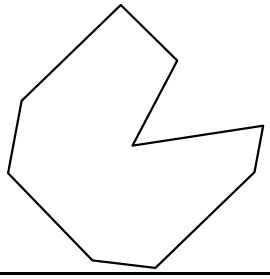

18)

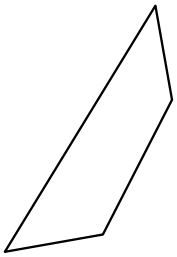

Ответы

1. _____
2. _____
3. _____
4. _____
5. _____
6. _____
7. _____
8. _____
9. _____
10. _____
11. _____
12. _____
13. _____
14. _____
15. _____
16. _____
17. _____
18. _____
19. _____
20. _____
21.

1-10	93	87	80	73	67	60	53	47	40	33
11-15	27	20	13	7	0					

Определение неправильных фигур Имя: Ключ к правильным ответам

Определите тип данных фигур.

1)

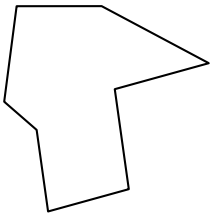

2)

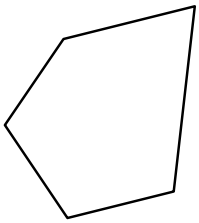

3)



4)

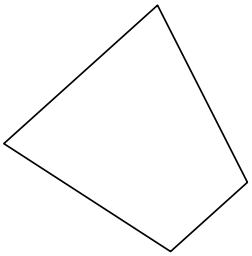

5)

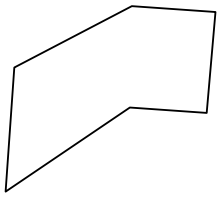

6)

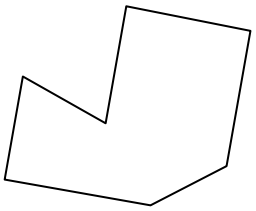

7)

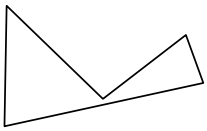

8)



9)

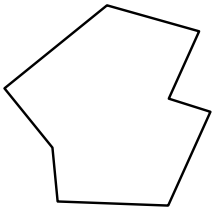

10)

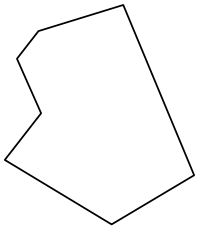

11)

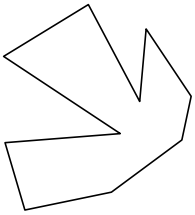

12)

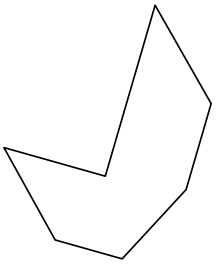

13)

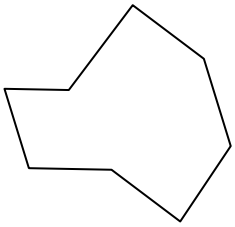

14)

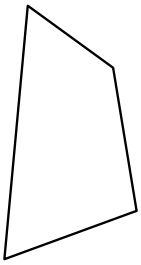

15)

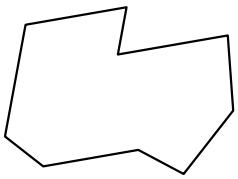

16)

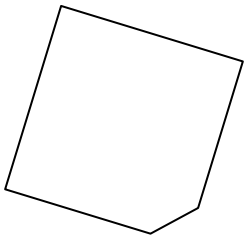

17)

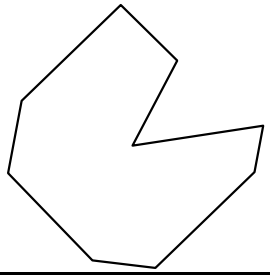

18)

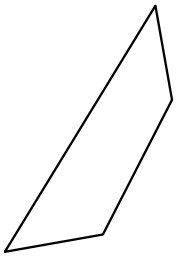

Ответы

1. восьмиугольник
2. пятиугольник
3. четырехугольник
4. четырехугольник
5. шестиугольник
6. семиугольник
7. пятиугольник
8. десятиугольник
9. восьмиугольник
10. семиугольник
11. десятиугольник
12. семиугольник
13. восьмиугольник
14. четырехугольник
15. девятиугольник
16. пятиугольник
17. девятиугольник
18. четырехугольник
19. семиугольник
20. шестиугольник
21. девятиугольник

1-10	93	87	80	73	67	60	53	47	40	33
11-15	27	20	13	7	0					