Определение фигур Имя:

Определите, какая фигура изображена перед нами.

1)

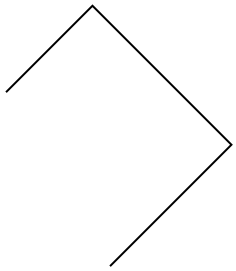

2)

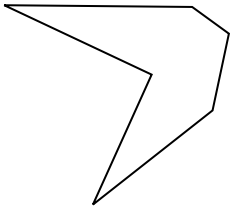

3)



4)

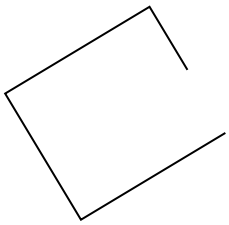

5)



6)

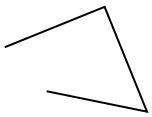

7)

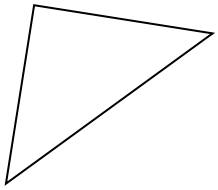

8)

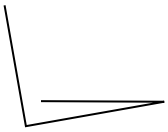

9)



10)

11)

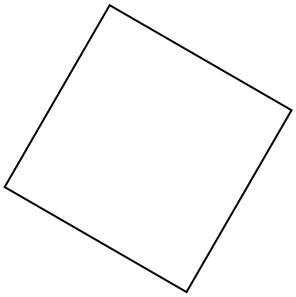

12)

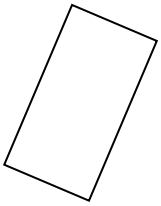

13)

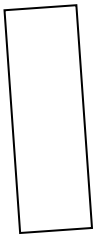

14)

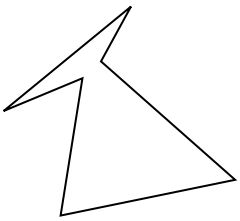

15)

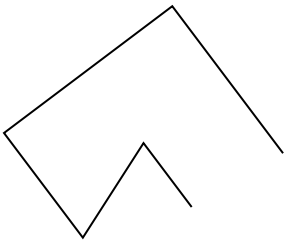

Ответы

1. _____
2. _____
3. _____
4. _____
5. _____
6. _____
7. _____
8. _____
9. _____
10. _____
11. _____
12. _____
13. _____
14. _____
15. _____

1-10	93	87	80	73	67	60	53	47	40	33
11-15	27	20	13	7	0					

Определение фигур

Имя: Ключ к правильным ответам

Определите, какая фигура изображена перед нами.

1) 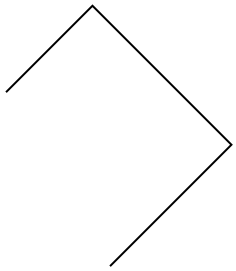

2) 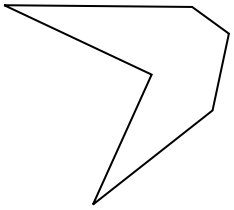

3) 

4) 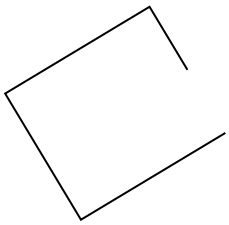

5) 

6) 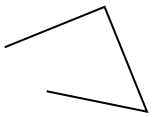

7) 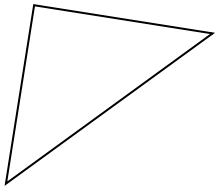

8) 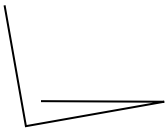

9) 

10)

11) 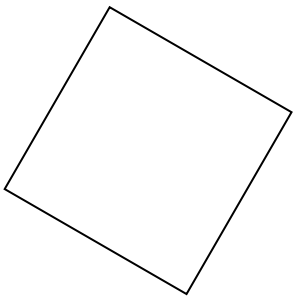

12) 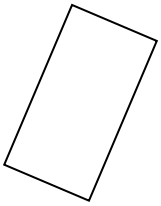

13) 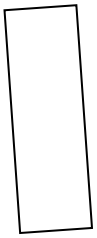

14) 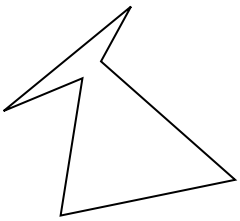

15) 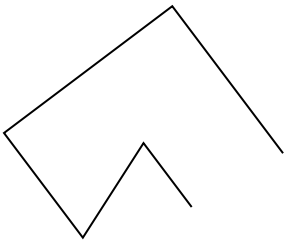

Ответы

1. другая
2. шестиугольник
3. прямоугольник
4. другая
5. другая
6. другая
7. треугольник
8. другая
9. шестиугольник
10. треугольник
11. квадрат
12. прямоугольник
13. прямоугольник
14. шестиугольник
15. другая

1-10	93	87	80	73	67	60	53	47	40	33
11-15	27	20	13	7	0					