Определение фигур Имя:

Определите, какая фигура изображена перед нами.

1)



2)

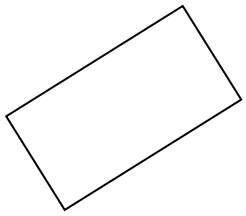

3)

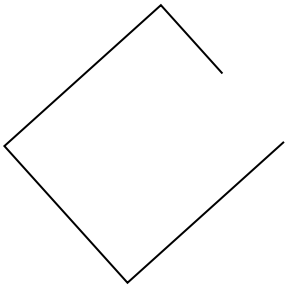

4)

5)



6)

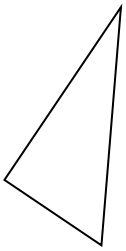

7)

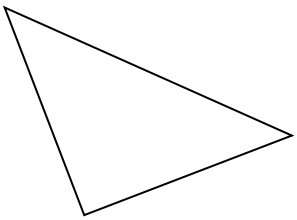

8)

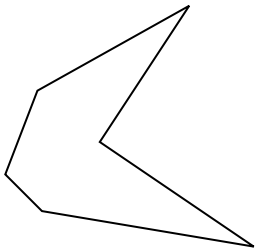

9)

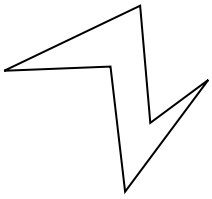

10)

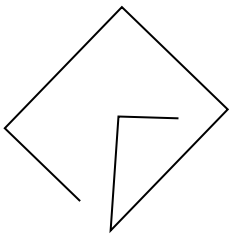

11)



12)

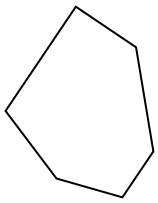

13)

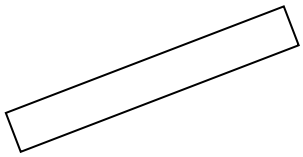

14)

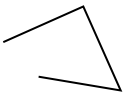

15)



Ответы

1. _____
2. _____
3. _____
4. _____
5. _____
6. _____
7. _____
8. _____
9. _____
10. _____
11. _____
12. _____
13. _____
14. _____
15. _____

1-10	93	87	80	73	67	60	53	47	40	33
11-15	27	20	13	7	0					

Определение фигур

Имя:

Ключ к правильным ответам

Определите, какая фигура изображена перед нами.

1)



2)

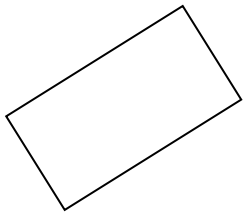

3)

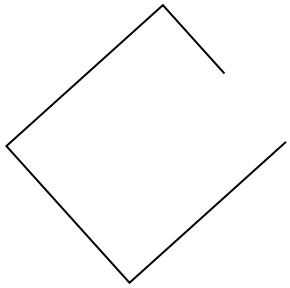

4)

5)



6)

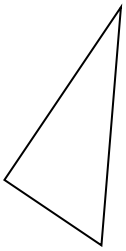

7)

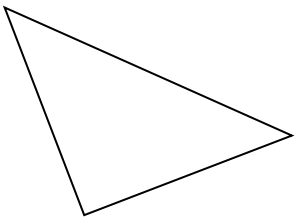

8)

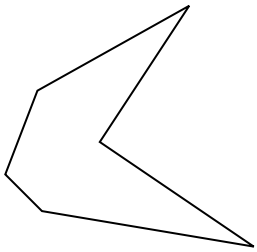

9)

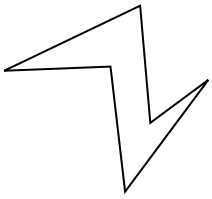

10)

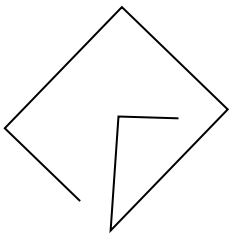

11)



12)

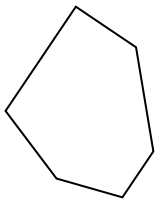

13)

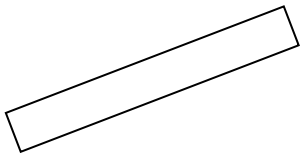

14)

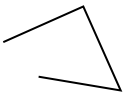

15)



Ответы

1. другая
2. прямоугольник
3. другая
4. прямоугольник
5. квадрат
6. треугольник
7. треугольник
8. шестиугольник
9. шестиугольник
10. другая
11. другая
12. шестиугольник
13. прямоугольник
14. другая
15. шестиугольник

1-10	93	87	80	73	67	60	53	47	40	33
11-15	27	20	13	7	0					