Округление по числовой прямой Имя:

Используйте числовые прямые для округления до десятков.

об) 51

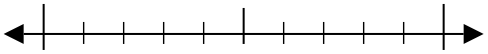

1) 83

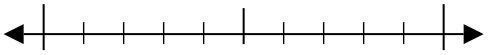

2) 49

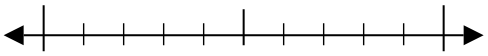

3) 62

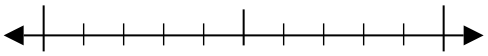

4) 726

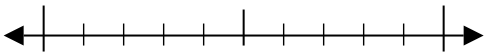

5) 716

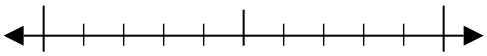

6) 813

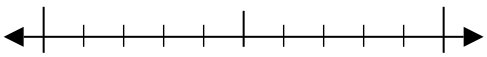

7) 131

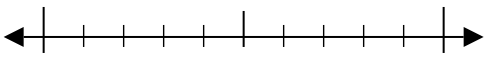

8) 5 409

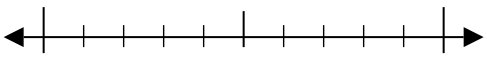

9) 8 102

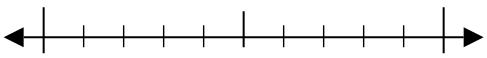

Ответы

об. 50

1. _____

2. _____

3. _____

4. _____

5. _____

6. _____

7. _____

8. _____

9. _____

1-9	89	78	67	56	44	33	22	11	0

Используйте числовые прямые для округления до десятков.

об)

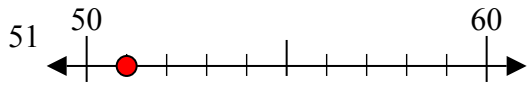

1)

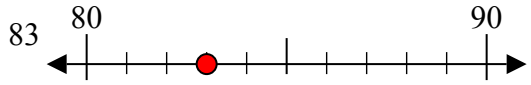

2)

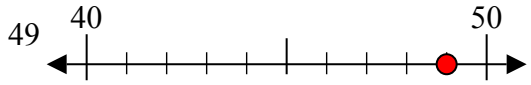

3)

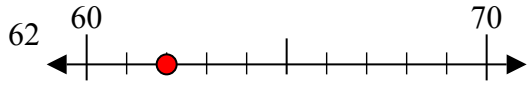

4)

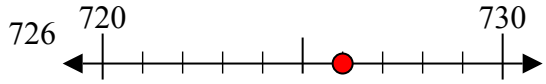

5)

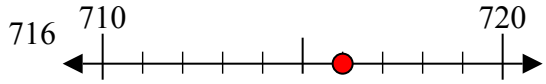

6)

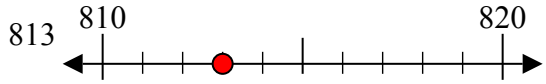

7)

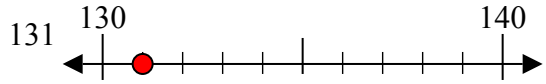

8)

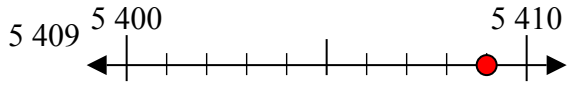

9)

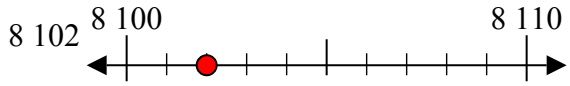

Ответы

об.	50
1.	80
2.	50
3.	60
4.	730
5.	720
6.	810
7.	130
8.	5410
9.	8100

1-9	89	78	67	56	44	33	22	11	0