Подбор цифровой линии к неравенству Имя:

Решите каждую задачу.

1) Какой вариант наиболее соответствует X > -5

A.

B.

C.

D.

2) Какой вариант наиболее соответствует X ≥ 12

A.

B. 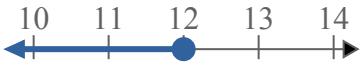

C. 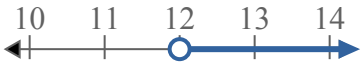

D. 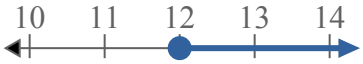

3) Какой вариант наиболее соответствует X ≤ 20

A.

B. 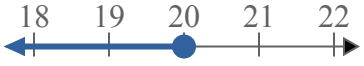

C.

D. 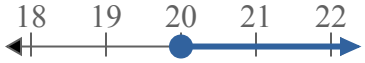

4) Какой вариант наиболее соответствует X ≥ -11

A. 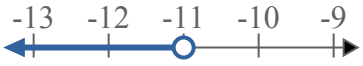

B. 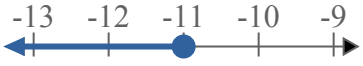

C. 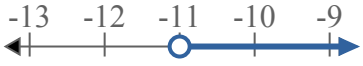

D. 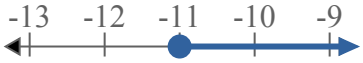

5) Какой вариант наиболее соответствует X > -3

A. 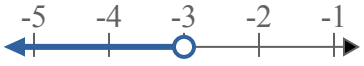

B. 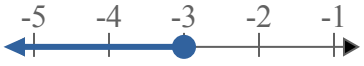

C. 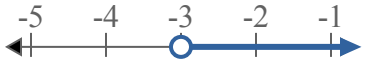

D. 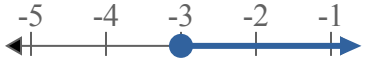

6) Какой вариант наиболее соответствует X > 5

A.

B. 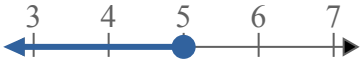

C.

D. 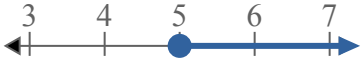

7) Какой вариант наиболее соответствует X ≤ 8

A. 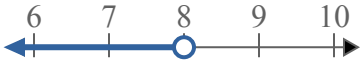

B. 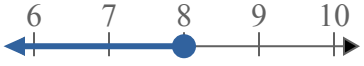

C. 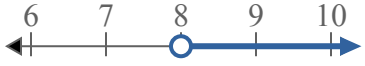

D. 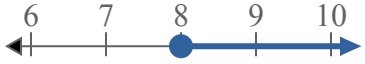

8) Какой вариант наиболее соответствует X ≤ -13

A. 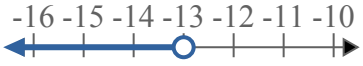

B.

C. 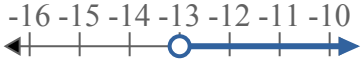

D. 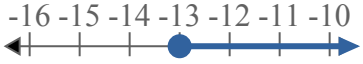

Ответы

1. _____
2. _____
3. _____
4. _____
5. _____
6. _____
7. _____
8. _____

1-8	88	75	63	50	38	25	13	0

Решите каждую задачу.

1) Какой вариант наиболее соответствует X > -5

A.

B.

C.

D.

2) Какой вариант наиболее соответствует X ≥ 12

A.

B. 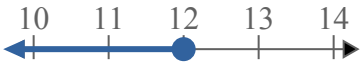

C. 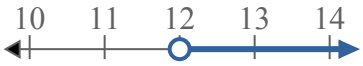

D. 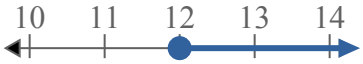

3) Какой вариант наиболее соответствует X ≤ 20

A.

B. 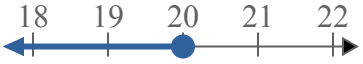

C.

D. 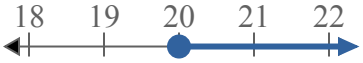

4) Какой вариант наиболее соответствует X ≥ -11

A. 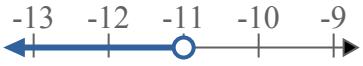

B.

C. 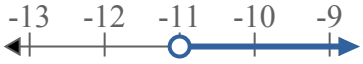

D. 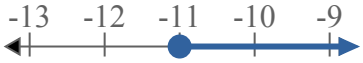

5) Какой вариант наиболее соответствует X > -3

A. 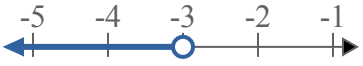

B. 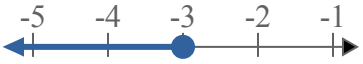

C.

D. 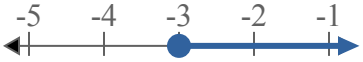

6) Какой вариант наиболее соответствует X > 5

A.

B.

C.

D. 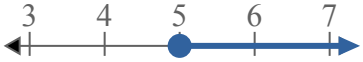

7) Какой вариант наиболее соответствует X ≤ 8

A. 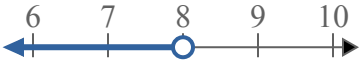

B. 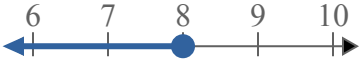

C. 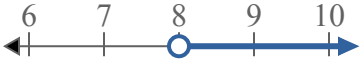

D. 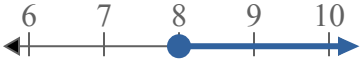

8) Какой вариант наиболее соответствует X ≤ -13

A. 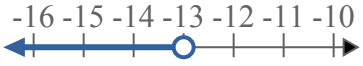

B.

C. 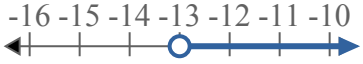

D. 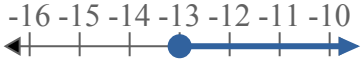

Ответы

1. C
2. D
3. B
4. D
5. C
6. C
7. B
8. B

1-8	88	75	63	50	38	25	13	0