Станки (Сложение и Вычитание) Имя:

Определите какой закон используется в станке.

об)

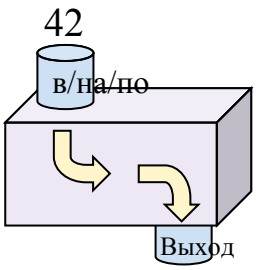

Вычесть 36

1)

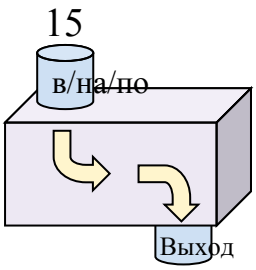

2)

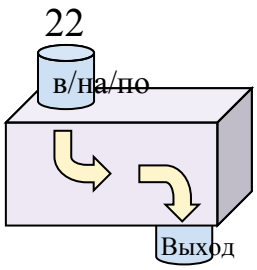

3)

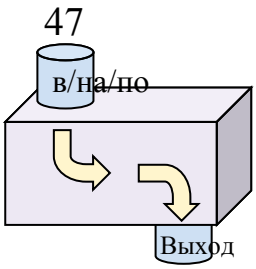

4)

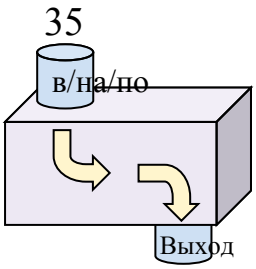

5)

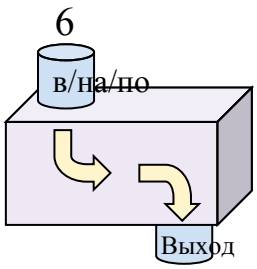

6)

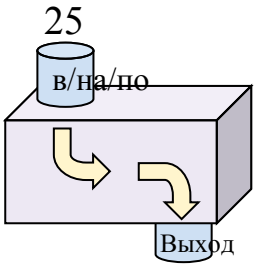

7)

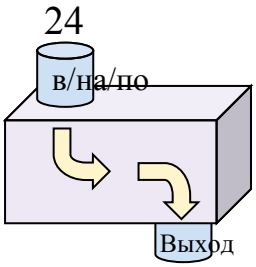

8)

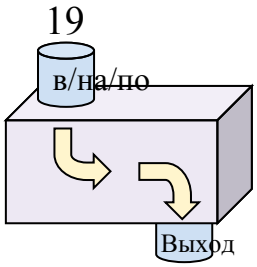

9)

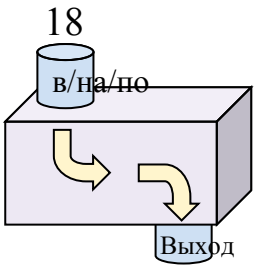

10)

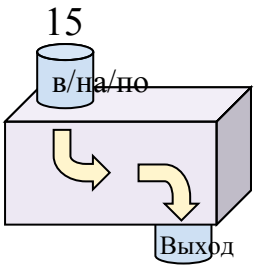

11)

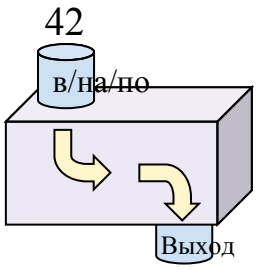

Ответы

об. Вычесть 36

1. _____
2. _____
3. _____
4. _____
5. _____
6. _____
7. _____
8. _____
9. _____
10. _____
11. _____

Станки (Сложение и Вычитание) Имя: Ключ к правильным ответам

Определите какой закон используется в станке.

об)

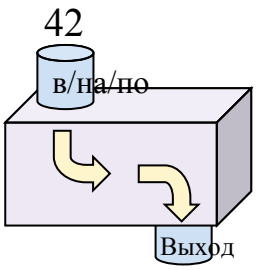

Вычесть 36

1)

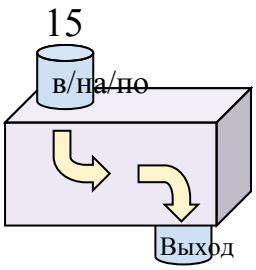

Добавить 19

2)

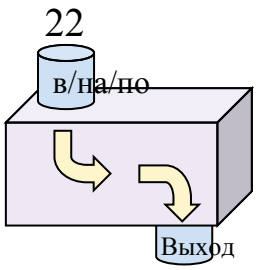

Добавить 7

3)

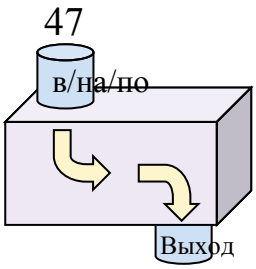

Вычесть 25

4)

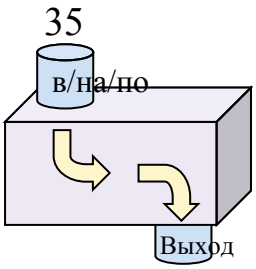

Вычесть 5

5)

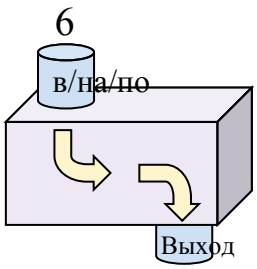

Добавить 31

6)

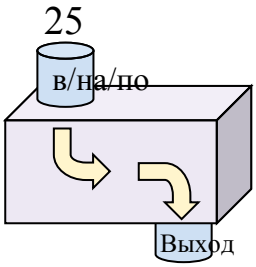

Добавить 24

7)

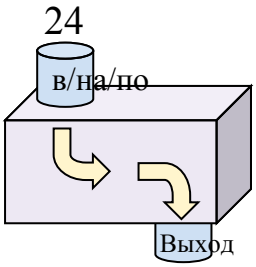

Добавить 19

8)

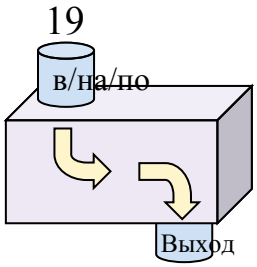

Вычесть 10

9)

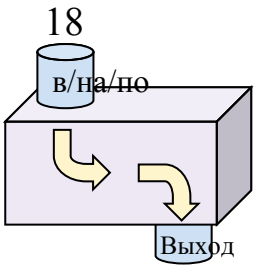

Вычесть 5

10)

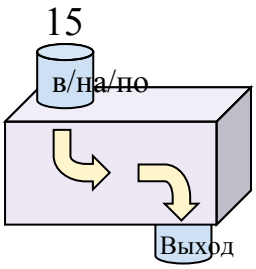

Добавить 23

11)

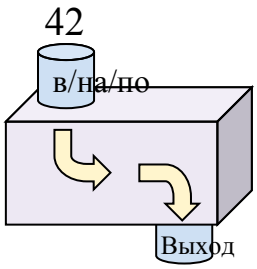

Вычесть 28

Ответы

об. Вычесть 36

1. Добавить 19

2. Добавить 7

3. Вычесть 25

4. Вычесть 5

5. Добавить 31

6. Добавить 24

7. Добавить 19

8. Вычесть 10

9. Вычесть 5

10. Добавить 23

11. Вычесть 28