Определите какой закон используется в станке.

об)

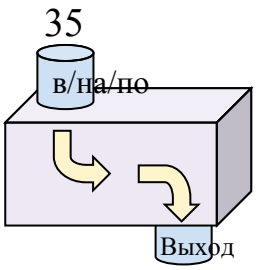

Вычесть 13

1)

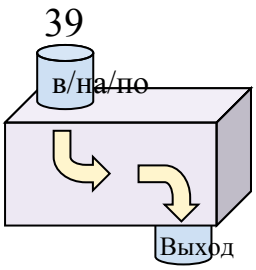

2)

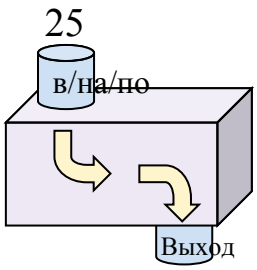

3)

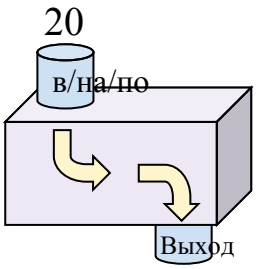

4)

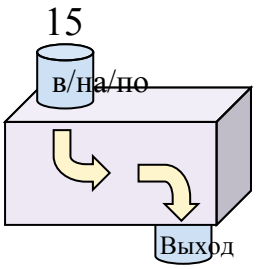

5)

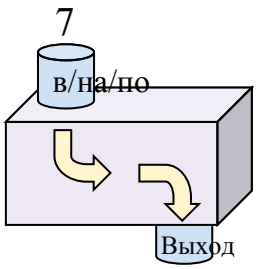

6)

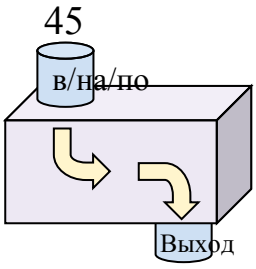

7)

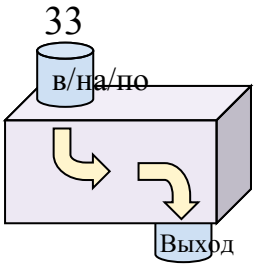

8)

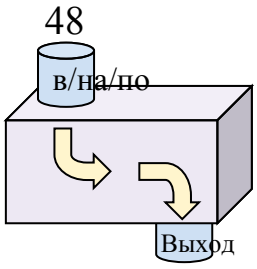

9)

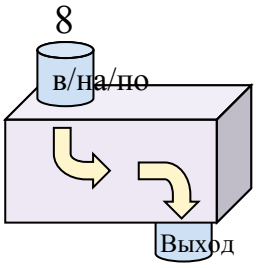

10)

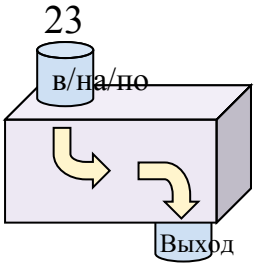

11)

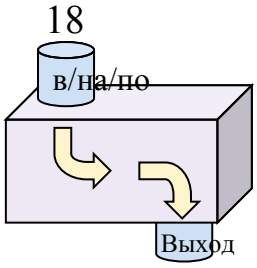

Ответы

об. Вычесть 13

1. _____
2. _____
3. _____
4. _____
5. _____
6. _____
7. _____
8. _____
9. _____
10. _____
11. _____

1-10	91	82	73	64	55	45	36	27	18	9
11	0									

Станки (Сложение и Вычитание) Имя: Ключ к правильным ответам

Определите какой закон используется в станке.

об)

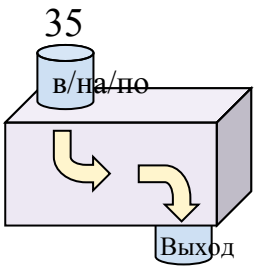

Вычесть 13

1)

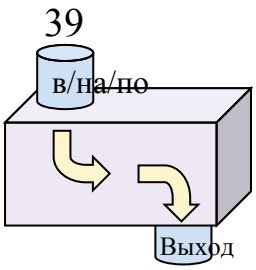

Вычесть 31

2)

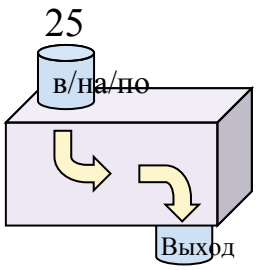

Добавить 10

3)

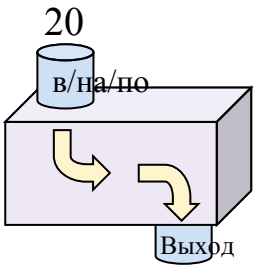

Добавить 8

4)

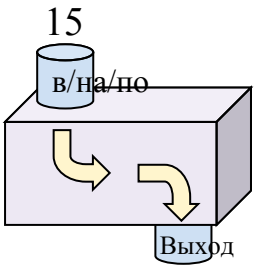

Добавить 34

5)

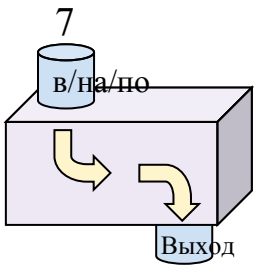

Добавить 21

6)

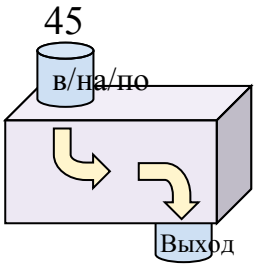

Вычесть 21

7)

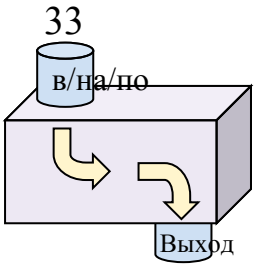

Вычесть 13

8)

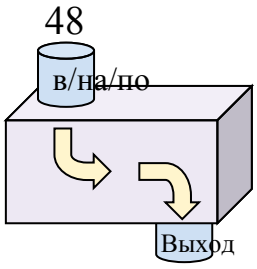

Вычесть 28

9)

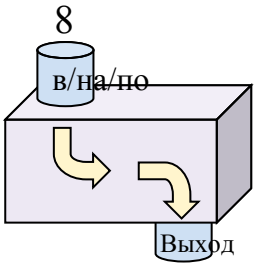

Добавить 38

10)

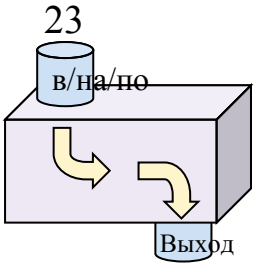

Добавить 12

11)

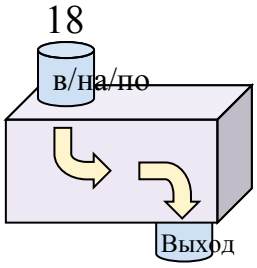

Добавить 6

Ответы

об. Вычесть 13

1. Вычесть 31

2. Добавить 10

3. Добавить 8

4. Добавить 34

5. Добавить 21

6. Вычесть 21

7. Вычесть 13

8. Вычесть 28

9. Добавить 38

10. Добавить 12

11. Добавить 6

1-10	91	82	73	64	55	45	36	27	18	9
11	0									