Станки (Сложение и Вычитание) Имя:

Определите какой закон используется в станке.

об)

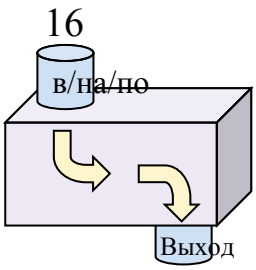

Добавить 12

1)

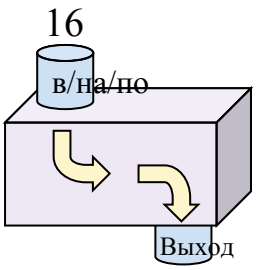

2)

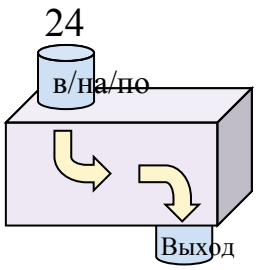

3)

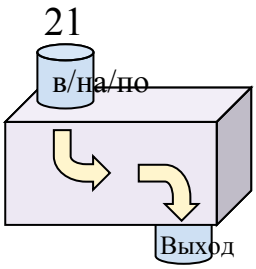

4)

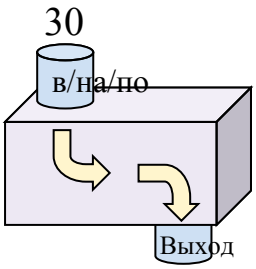

5)

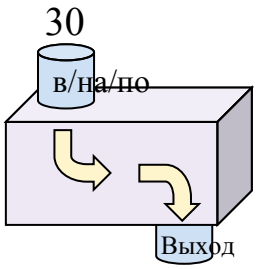

6)

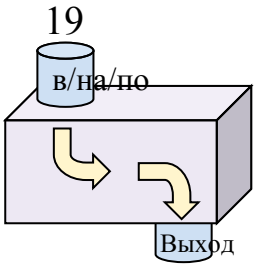

7)

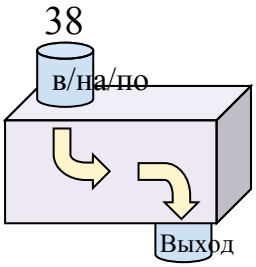

8)

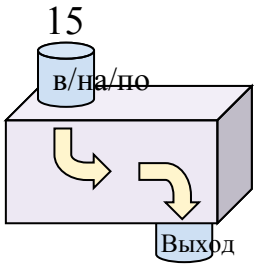

9)

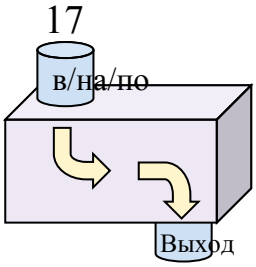

10)

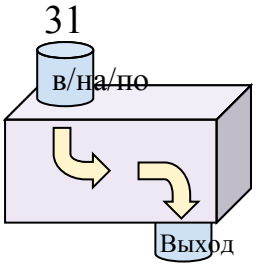

11)

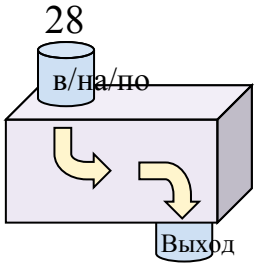

Ответы

об. Добавить 12

1. _____
2. _____
3. _____
4. _____
5. _____
6. _____
7. _____
8. _____
9. _____
10. _____
11. _____

1-10	91	82	73	64	55	45	36	27	18	9
11	0									

Станки (Сложение и Вычитание) Имя: Ключ к правильным ответам

Определите какой закон используется в станке.

об)

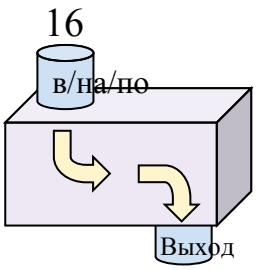

Добавить 12

1)

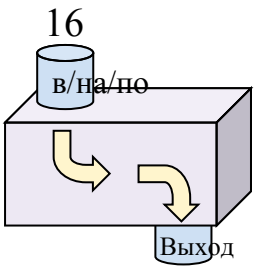

Добавить 6

2)

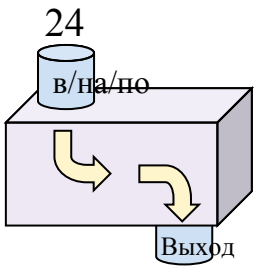

Вычесть 17

3)

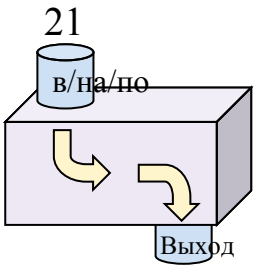

Добавить 14

4)

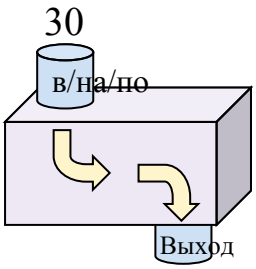

Вычесть 17

5)

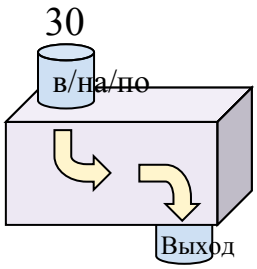

Вычесть 7

6)

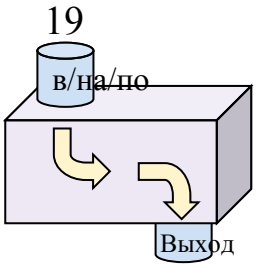

Добавить 13

7)

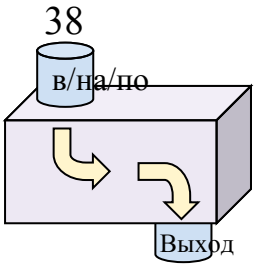

Вычесть 17

8)

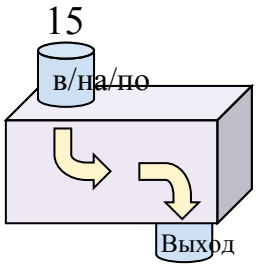

Добавить 8

9)

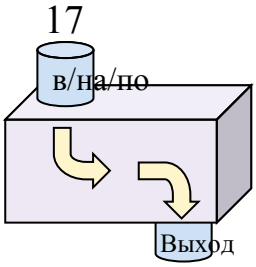

Добавить 15

10)

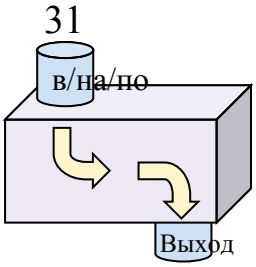

Вычесть 24

11)

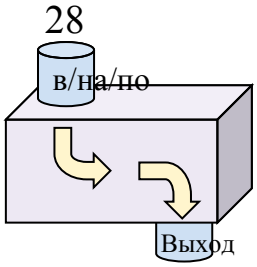

Вычесть 18

Ответы

об. Добавить 12

1. Добавить 6

2. Вычесть 17

3. Добавить 14

4. Вычесть 17

5. Вычесть 7

6. Добавить 13

7. Вычесть 17

8. Добавить 8

9. Добавить 15

10. Вычесть 24

11. Вычесть 18

1-10	91	82	73	64	55	45	36	27	18	9
11	0									