Написание задач на умножение Имя:

Определите, как нужно изобразить численно данные задачи.

об)



1)

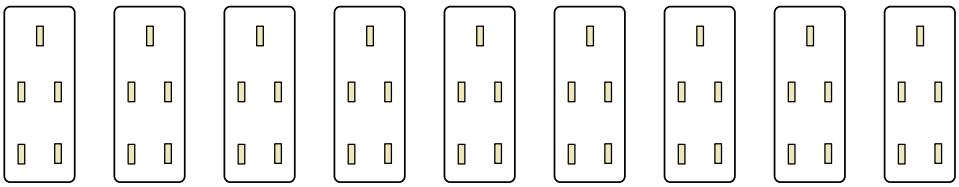

2)

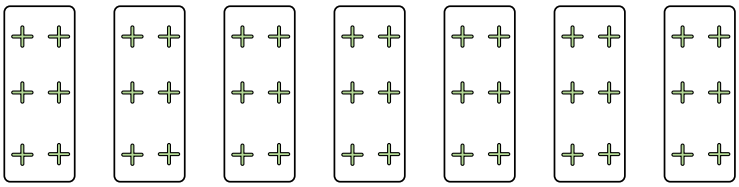

3)



4)

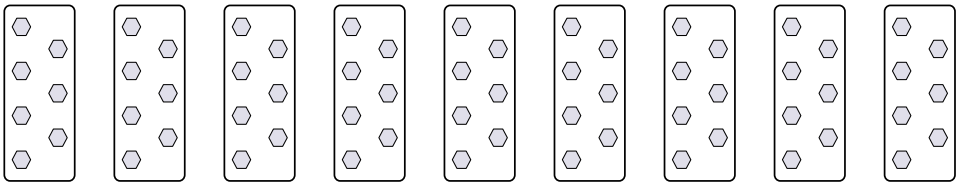

5)

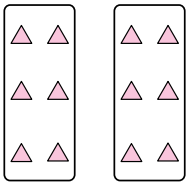

6)

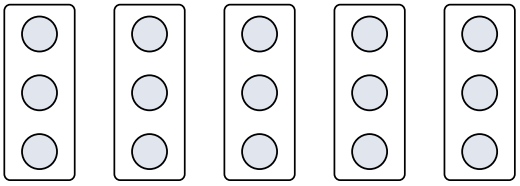

7)



8)

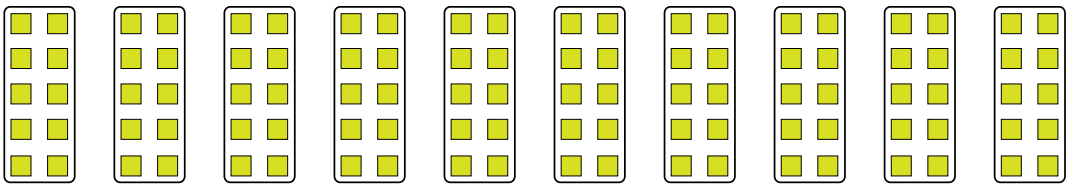

Ответы

об. 7×8=56

1. _____

2. _____

3. _____

4. _____

5. _____

6. _____

7. _____

8. _____

Написание задач на умножение

Имя: Ключ к правильным ответам

Определите, как нужно изобразить численно данные задачи.

об)



1)

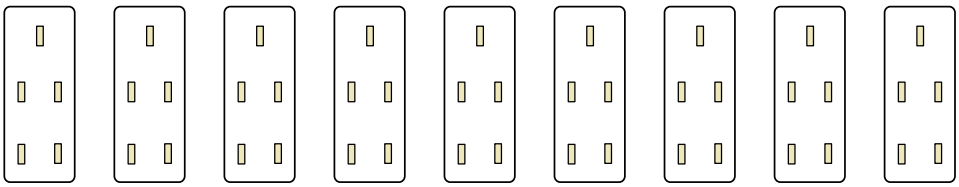

2)

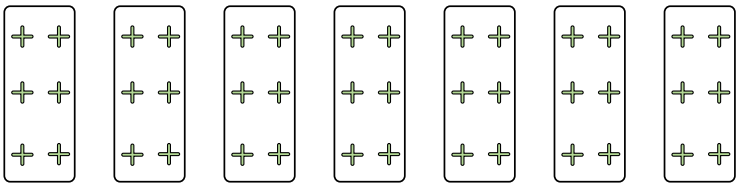

3)



4)

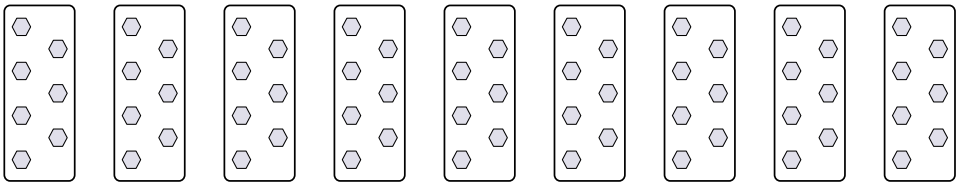

5)

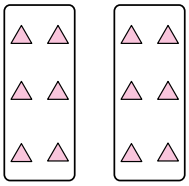

6)

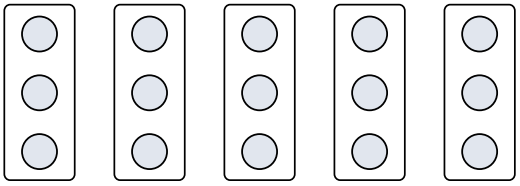

7)



8)

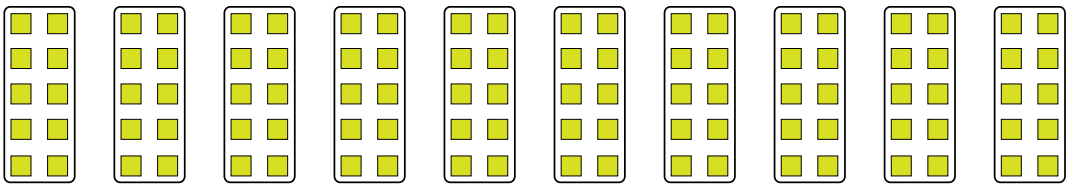

Ответы

об. 7×8=56

1. 9×5=45

2. 7×6=42

3. 2×7=14

4. 9×7=63

5. 2×6=12

6. 5×3=15

7. 4×5=20

8. 10×10=100

1-8	88	75	63	50	38	25	13	0