Написание задач на умножение Имя:

Определите, как нужно изобразить численно данные задачи.

об)

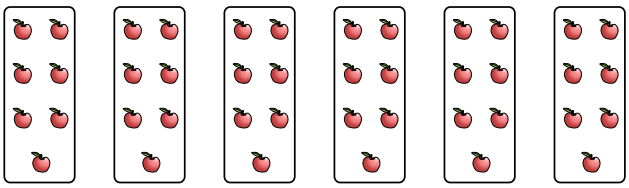

1)

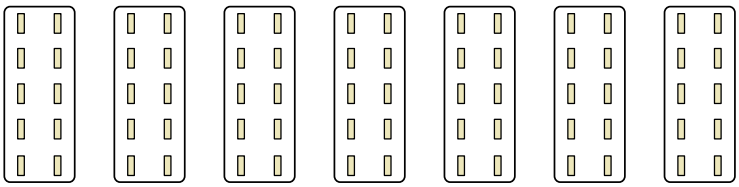

2)

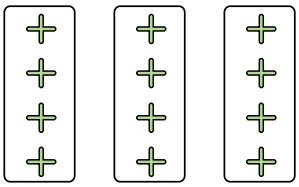

3)



4)

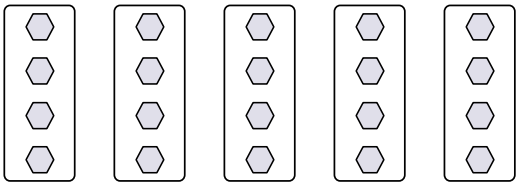

5)

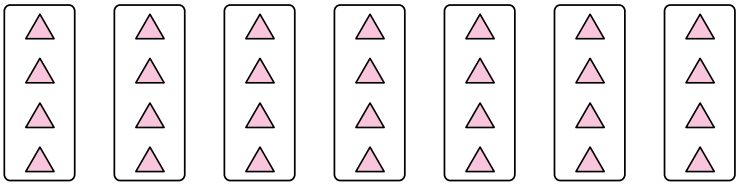

6)

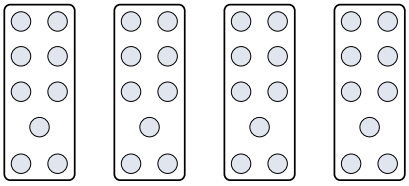

7)



8)

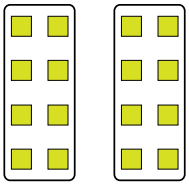

Ответы

об. $6\times7=42$

1. _____

2. _____

3. _____

4. _____

5. _____

6. _____

7. _____

8. _____

1-8	88	75	63	50	38	25	13	0

Написание задач на умножение

Имя: Ключ к правильным ответам

Определите, как нужно изобразить численно данные задачи.

об)

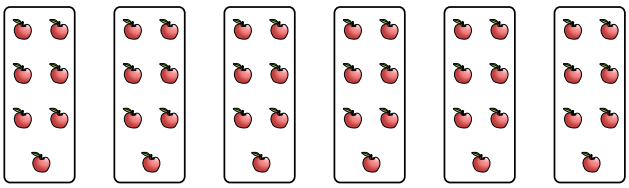

1)

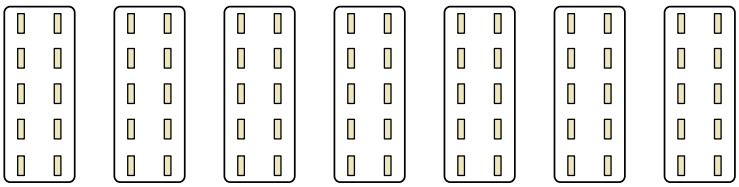

2)

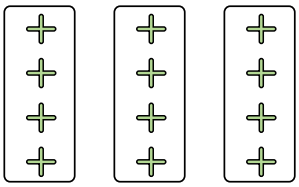

3)



4)

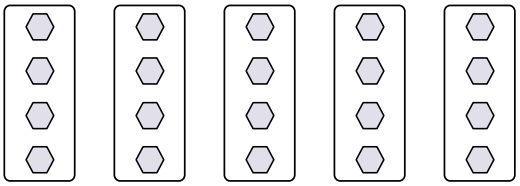

5)

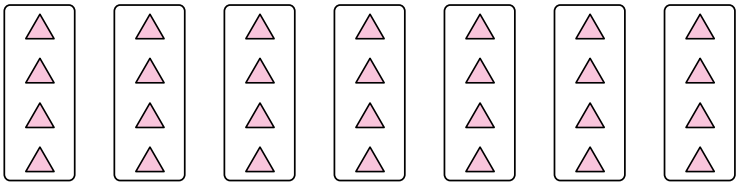

6)

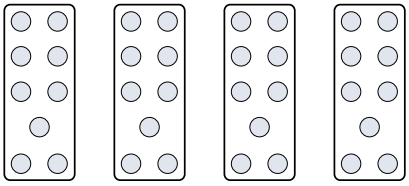

7)



8)

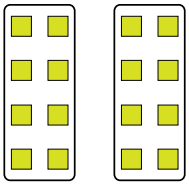

Ответы

об. 6×7=42

1. 7×10=70

2. 3×4=12

3. 3×7=21

4. 5×4=20

5. 7×4=28

6. 4×9=36

7. 4×10=40

8. 2×8=16

1-8	88	75	63	50	38	25	13	0