Сравнение длины объектов Имя:

Расположите объекты от меньшего к большему.

1)

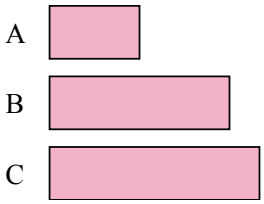

2)

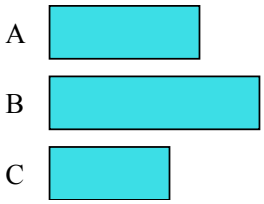

3)

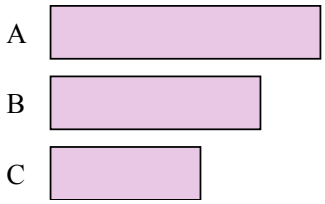

4)

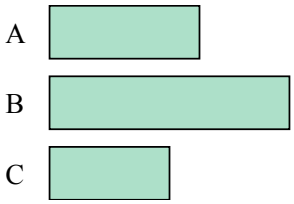

5)

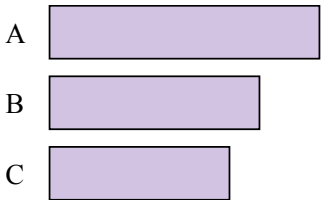

6)

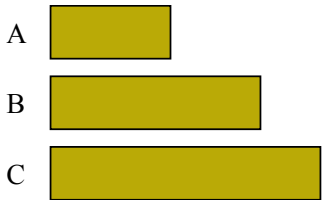

7)

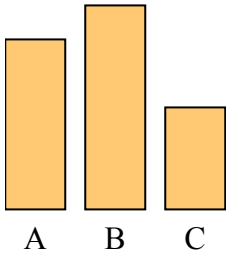

8)

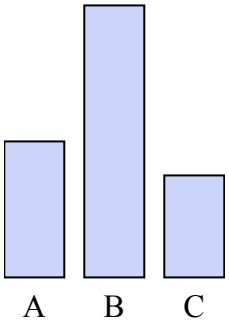

9)

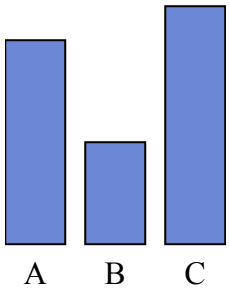

10)

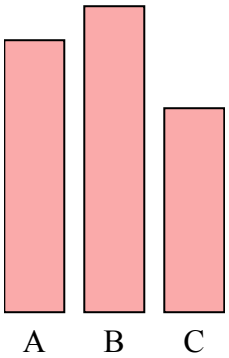

11)



12)

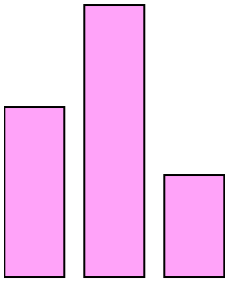

Ответы

1. _____
2. _____
3. _____
4. _____
5. _____
6. _____
7. _____
8. _____
9. _____
10. _____
11. _____
12. _____

1-10	90	80	70	60	50	40	30	20	10	0

Сравнение длины объектов

Имя: **Ключ к правильным ответам**

Расположите объекты от меньшего к большему.

1)

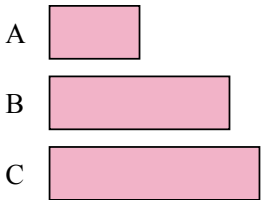

2)

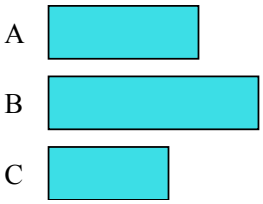

3)

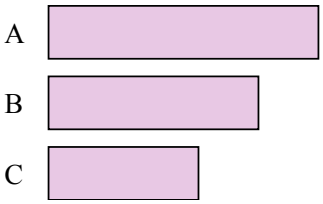

4)

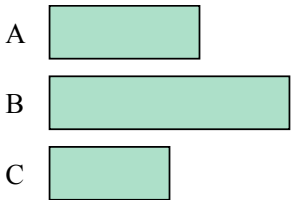

5)

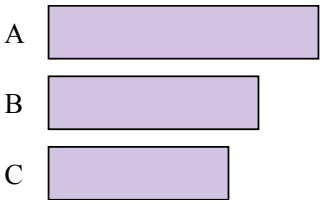

6)

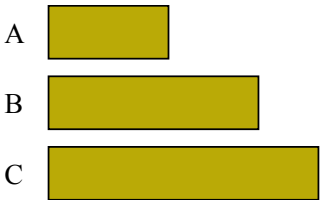

7)

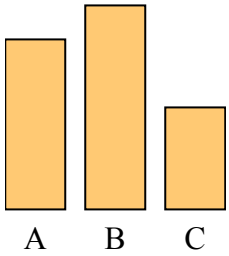

8)

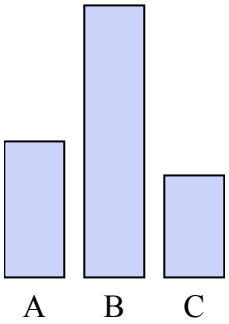

9)

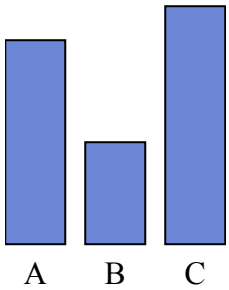

10)

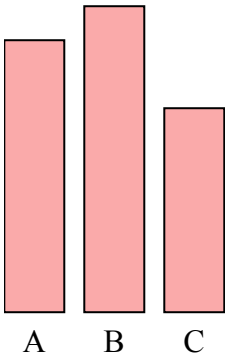

11)



12)

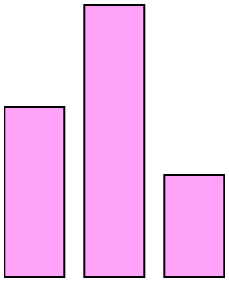

Ответы

1. **A, B, C**
2. **C, A, B**
3. **C, B, A**
4. **C, A, B**
5. **C, B, A**
6. **A, B, C**
7. **C, A, B**
8. **C, A, B**
9. **B, A, C**
10. **C, A, B**
11. **B, C, A**
12. **C, A, B**

1-10	90	80	70	60	50	40	30	20	10	0

Сравнение длины объектов Имя:

Расположите объекты от меньшего к большему.

1)

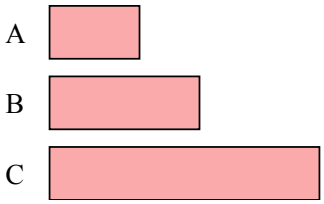

2)

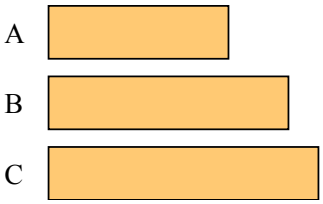

3)

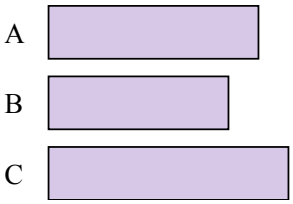

4)

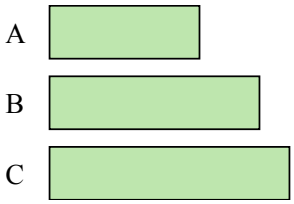

5)

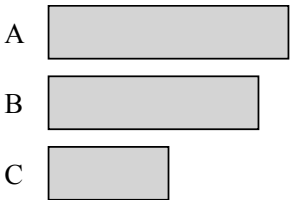

6)

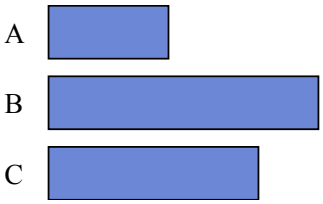

7)

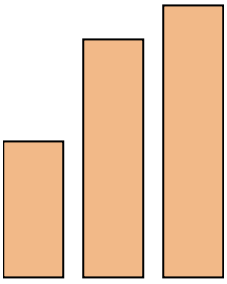

8)

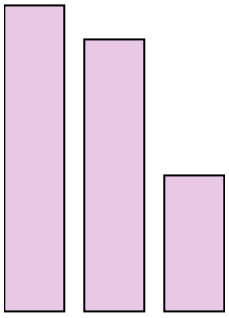

9)

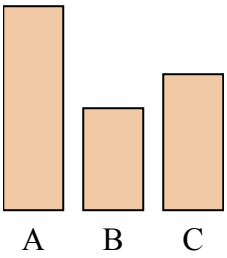

10)

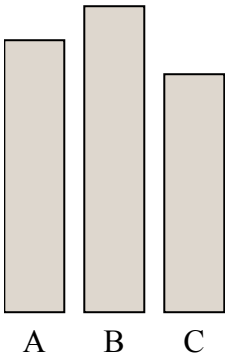

11)

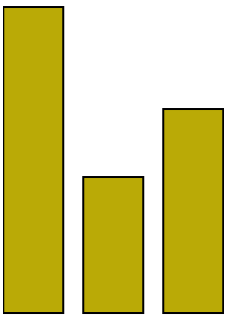

12)

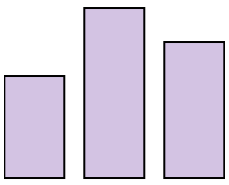

Ответы

1. _____
2. _____
3. _____
4. _____
5. _____
6. _____
7. _____
8. _____
9. _____
10. _____
11. _____
12. _____

1-10	90	80	70	60	50	40	30	20	10	0

Сравнение длины объектов

Имя: **Ключ к правильным ответам**

Расположите объекты от меньшего к большему.

1)

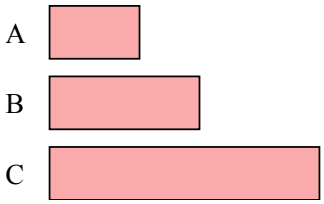

2)

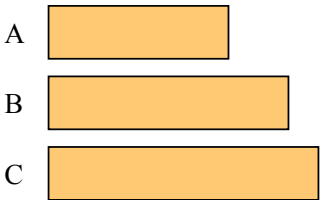

3)

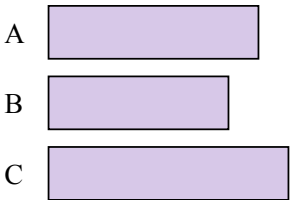

4)

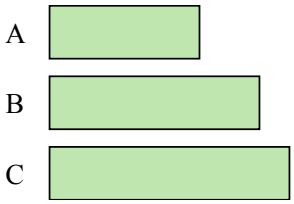

5)

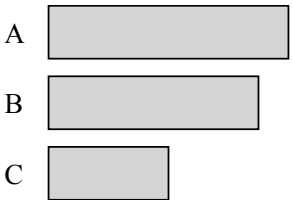

6)

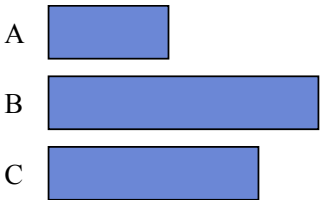

7)

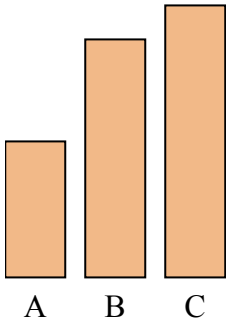

8)

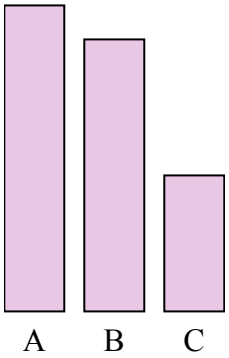

9)

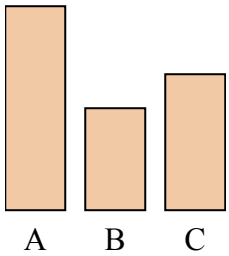

10)

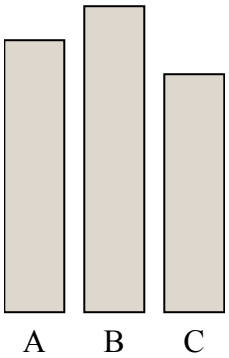

11)

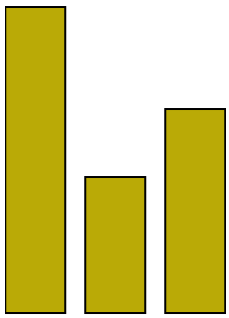

12)

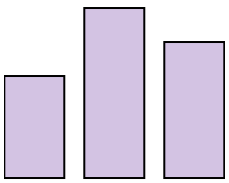

Ответы

1. A, B, C
2. A, B, C
3. B, A, C
4. A, B, C
5. C, B, A
6. A, C, B
7. A, B, C
8. C, B, A
9. B, C, A
10. C, A, B
11. B, C, A
12. A, C, B

1-10	90	80	70	60	50	40	30	20	10	0

Сравнение длины объектов Имя:

Расположите объекты от меньшего к большему.

1)

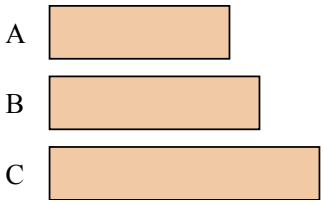

2)

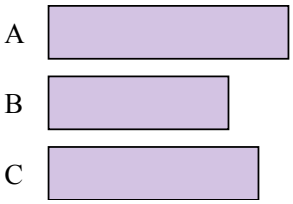

3)

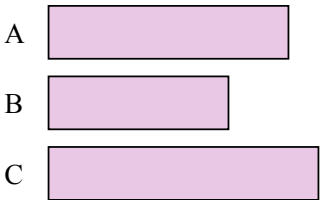

4)

5)

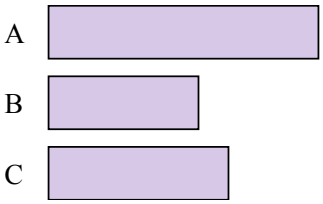

6)

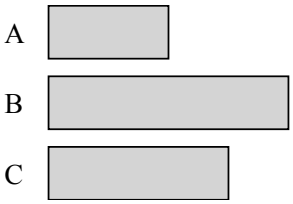

7)

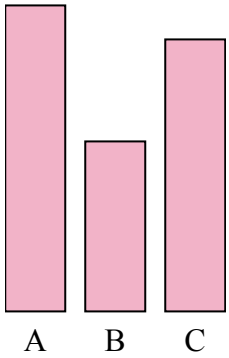

8)

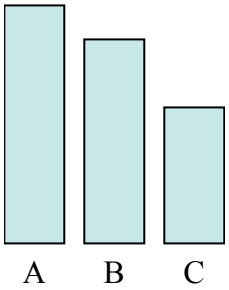

9)

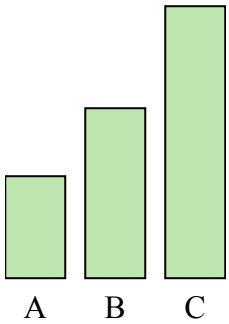

10)

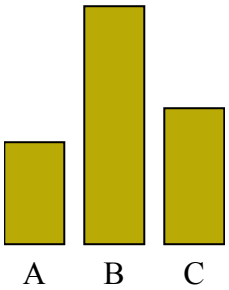

11)

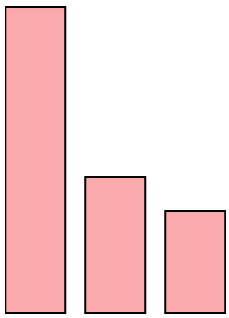

12)

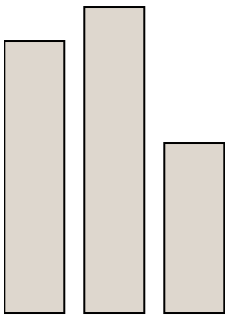

Ответы

1. _____
2. _____
3. _____
4. _____
5. _____
6. _____
7. _____
8. _____
9. _____
10. _____
11. _____
12. _____

1-10	90	80	70	60	50	40	30	20	10	0

Сравнение длины объектов

Имя: **Ключ к правильным ответам**

Расположите объекты от меньшего к большему.

1)

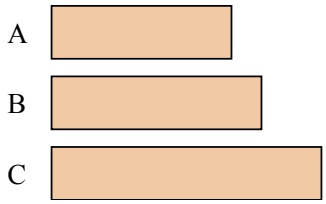

2)

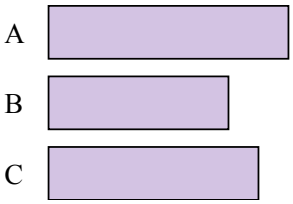

3)

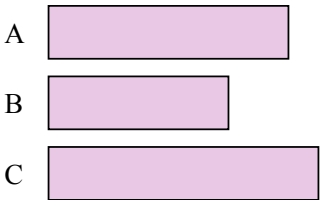

4)

5)

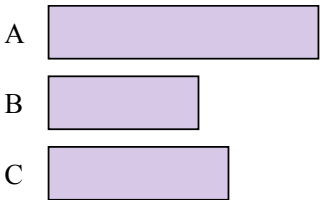

6)

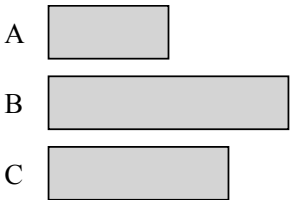

7)

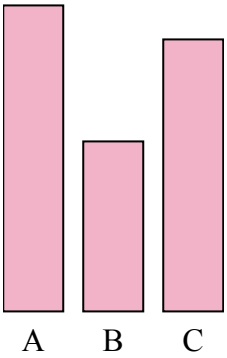

8)

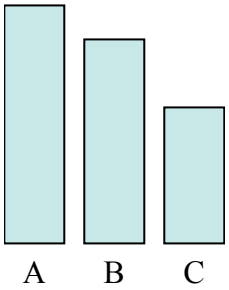

9)

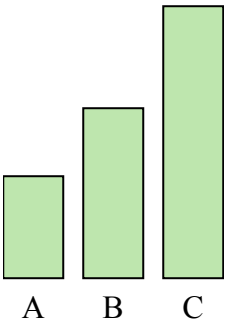

10)

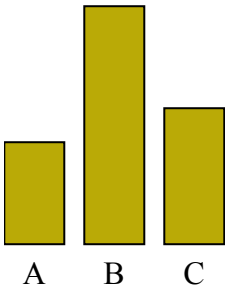

11)

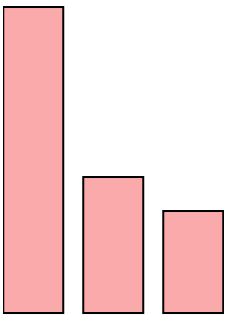

12)

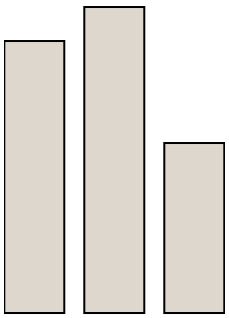

Ответы

1. **A, B, C**
2. **B, C, A**
3. **B, A, C**
4. **A, C, B**
5. **B, C, A**
6. **A, C, B**
7. **B, C, A**
8. **C, B, A**
9. **A, B, C**
10. **A, C, B**
11. **C, B, A**
12. **C, A, B**

1-10	90	80	70	60	50	40	30	20	10	0

Сравнение длины объектов Имя:

Расположите объекты от меньшего к большему.

1)

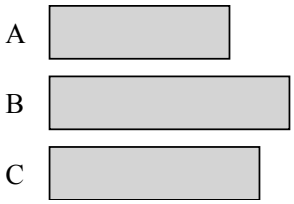

2)

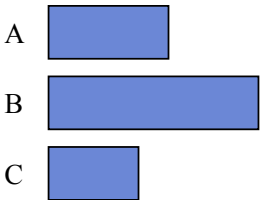

3)

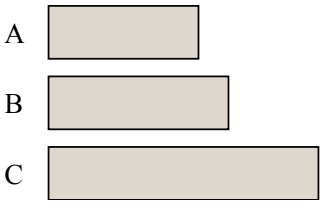

4)

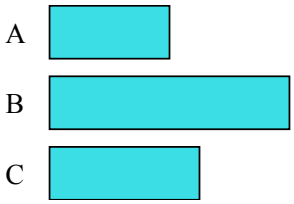

5)

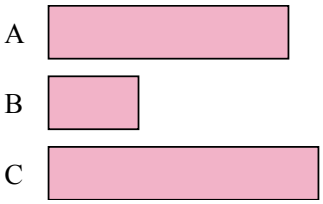

6)

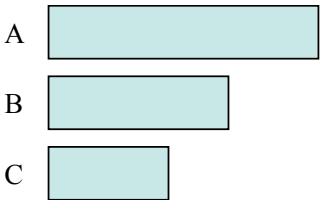

7)

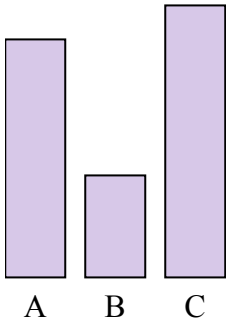

8)

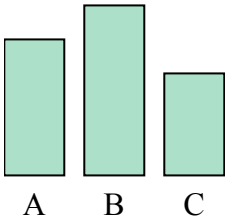

9)

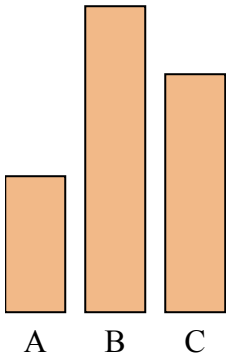

10)

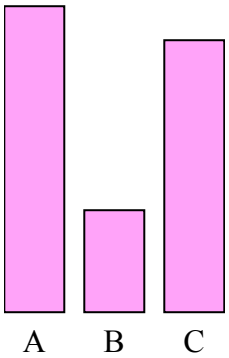

11)

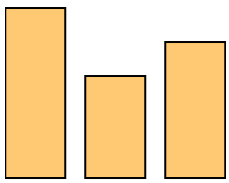

12)

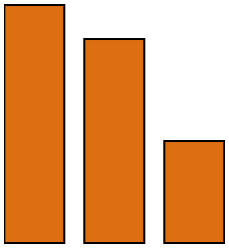

Ответы

1. _____
2. _____
3. _____
4. _____
5. _____
6. _____
7. _____
8. _____
9. _____
10. _____
11. _____
12. _____

1-10	90	80	70	60	50	40	30	20	10	0

Сравнение длины объектов

Имя: **Ключ к правильным ответам**

Расположите объекты от меньшего к большему.

1)

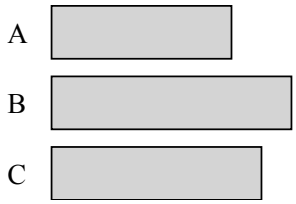

2)

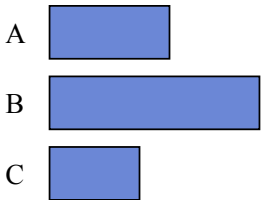

3)

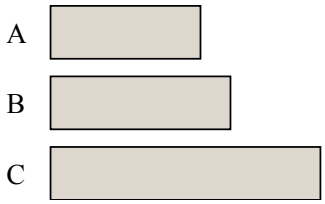

4)

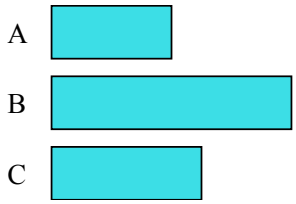

5)

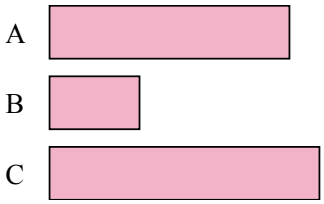

6)

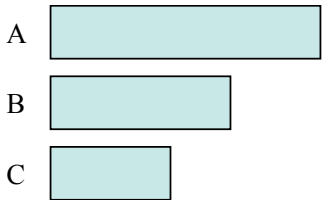

7)

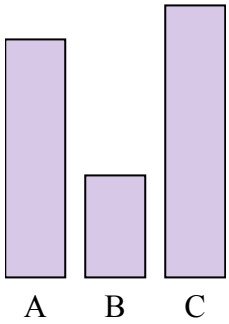

8)

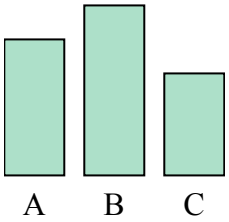

9)

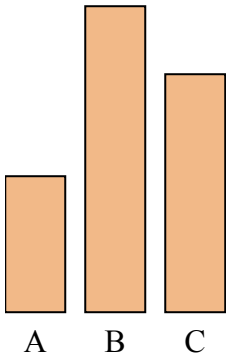

10)

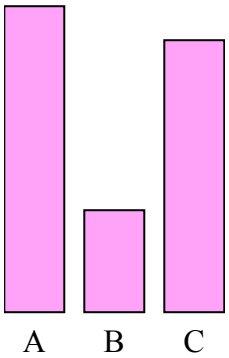

11)

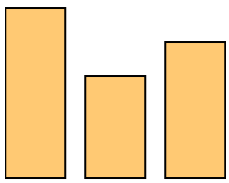

12)

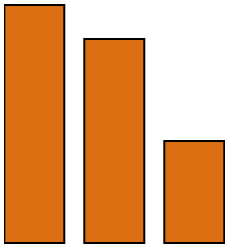

Ответы

1. **A, C, B**
2. **C, A, B**
3. **A, B, C**
4. **A, C, B**
5. **B, A, C**
6. **C, B, A**
7. **B, A, C**
8. **C, A, B**
9. **A, C, B**
10. **B, C, A**
11. **B, C, A**
12. **C, B, A**

1-10	90	80	70	60	50	40	30	20	10	0

Сравнение длины объектов Имя:

Расположите объекты от меньшего к большему.

1)

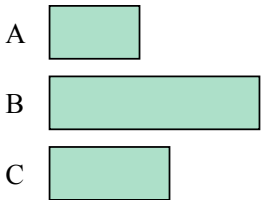

2)

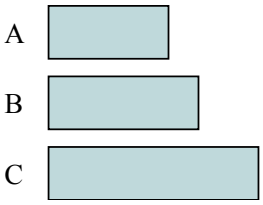

3)

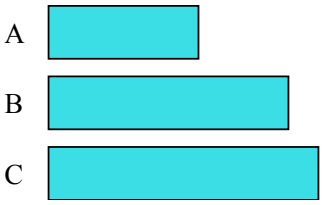

4)

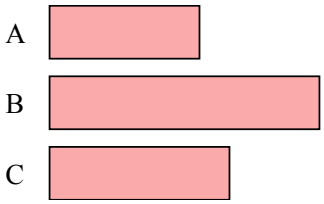

5)

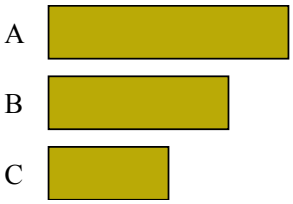

6)

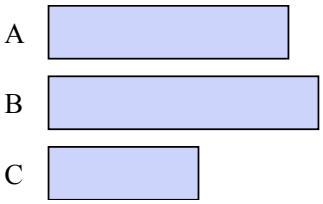

7)

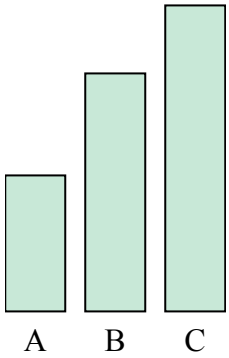

8)

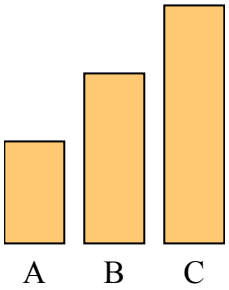

9)

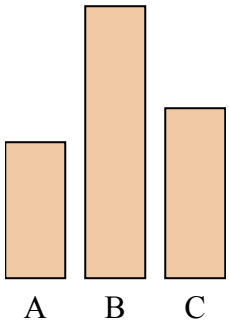

10)

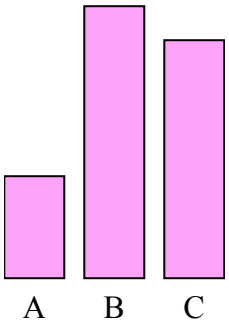

11)

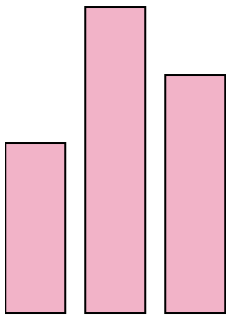

12)

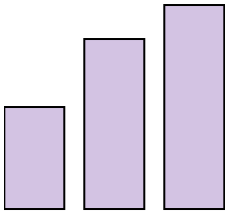

Ответы

1. _____
2. _____
3. _____
4. _____
5. _____
6. _____
7. _____
8. _____
9. _____
10. _____
11. _____
12. _____

1-10	90	80	70	60	50	40	30	20	10	0

Сравнение длины объектов

Имя: **Ключ к правильным ответам**

Расположите объекты от меньшего к большему.

1)

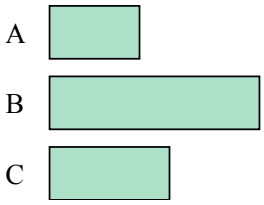

2)

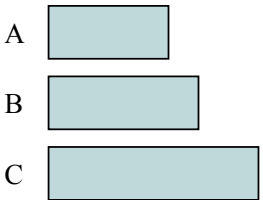

3)

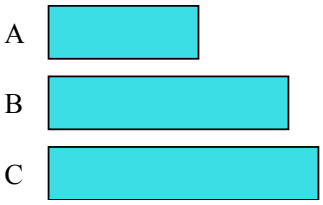

4)

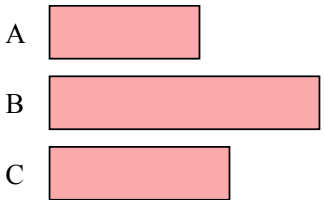

5)

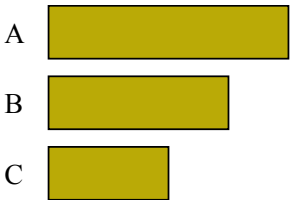

6)

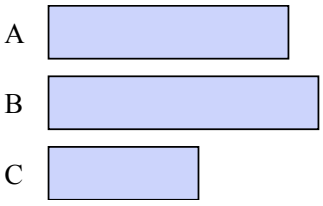

7)

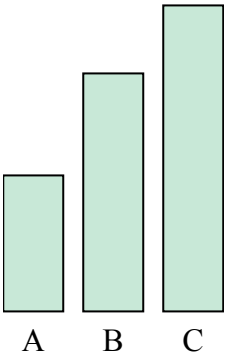

8)

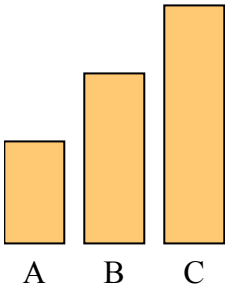

9)



10)

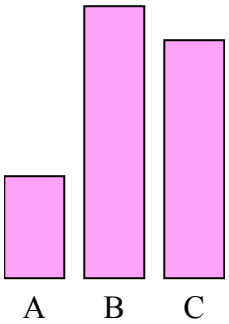

11)

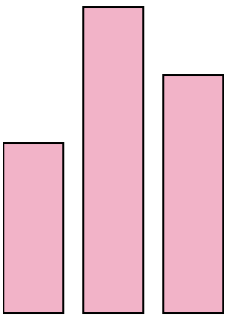

12)

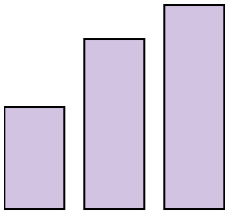

Ответы

1. **A, C, B**
2. **A, B, C**
3. **A, B, C**
4. **A, C, B**
5. **C, B, A**
6. **C, A, B**
7. **A, B, C**
8. **A, B, C**
9. **A, C, B**
10. **A, C, B**
11. **A, C, B**
12. **A, B, C**

1-10	90	80	70	60	50	40	30	20	10	0

Сравнение длины объектов Имя:

Расположите объекты от меньшего к большему.

1)



2)

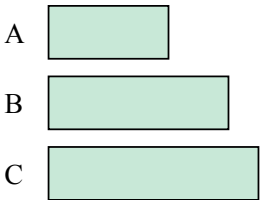

3)

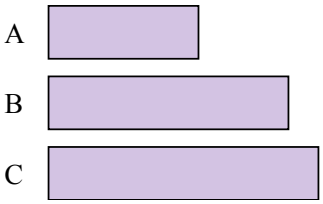

4)

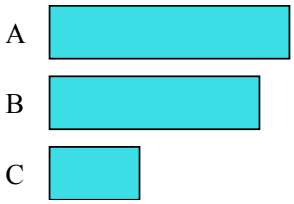

5)

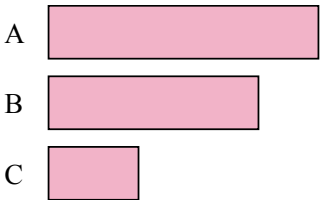

6)

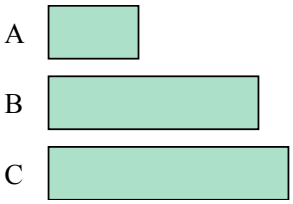

7)

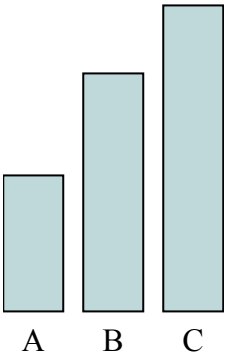

8)

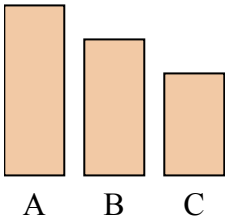

9)



10)



11)

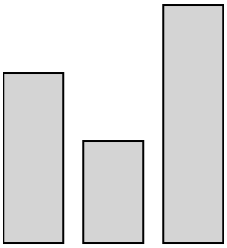

12)

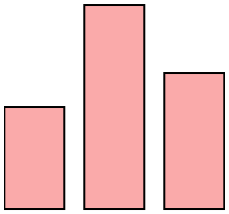

Ответы

1. _____
2. _____
3. _____
4. _____
5. _____
6. _____
7. _____
8. _____
9. _____
10. _____
11. _____
12. _____

1-10	90	80	70	60	50	40	30	20	10	0

Сравнение длины объектов

Имя: **Ключ к правильным ответам**

Расположите объекты от меньшего к большему.

1)



2)

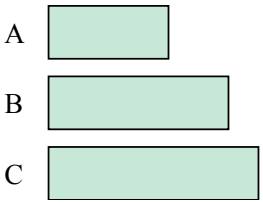

3)

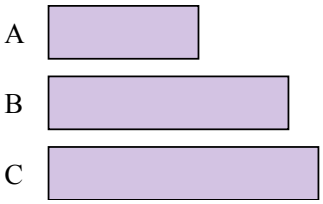

4)

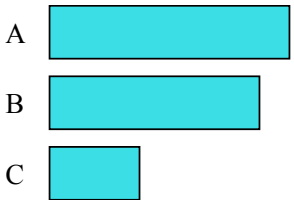

5)

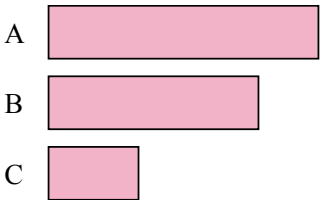

6)

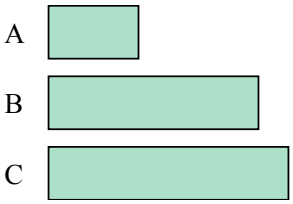

7)

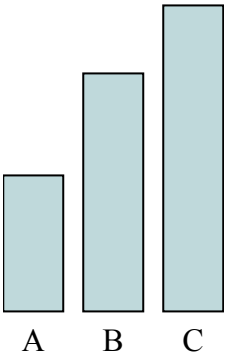

8)

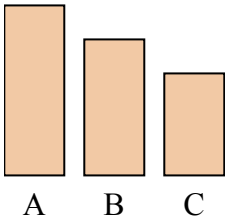

9)



10)



11)

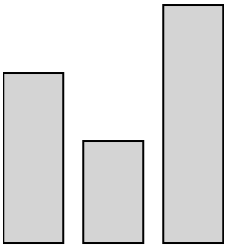

12)

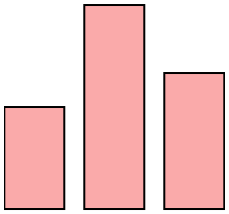

Ответы

1. **C, B, A**
2. **A, B, C**
3. **A, B, C**
4. **C, B, A**
5. **C, B, A**
6. **A, B, C**
7. **A, B, C**
8. **C, B, A**
9. **C, A, B**
10. **A, B, C**
11. **B, A, C**
12. **A, C, B**

1-10	90	80	70	60	50	40	30	20	10	0

Сравнение длины объектов Имя:

Расположите объекты от меньшего к большему.

1)

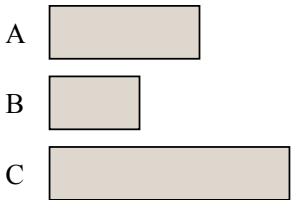

2)

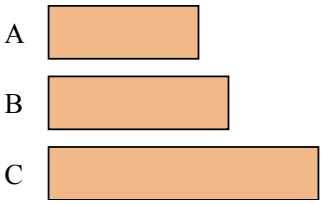

3)

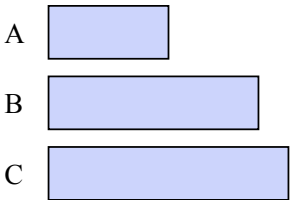

4)

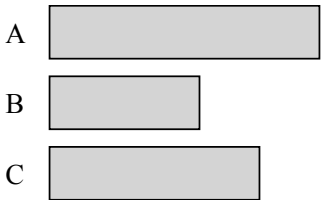

5)

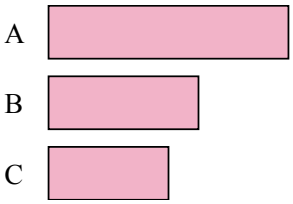

6)

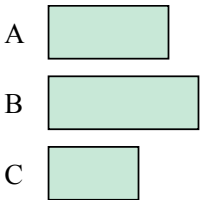

7)

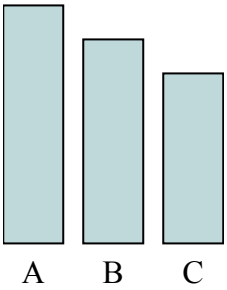

8)

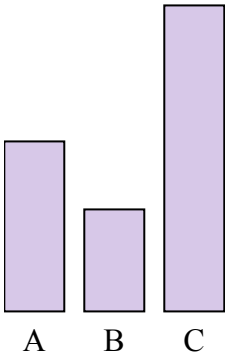

9)

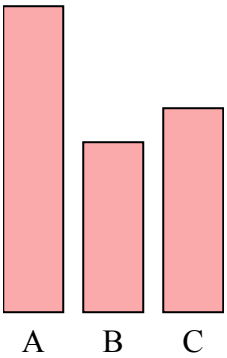

10)

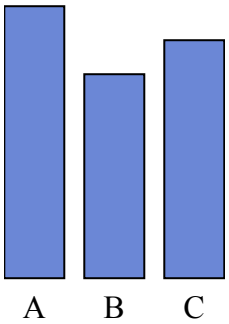

11)

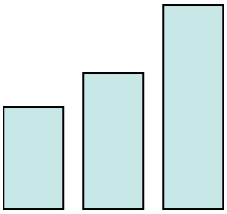

12)

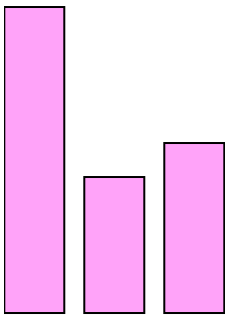

Ответы

1. _____
2. _____
3. _____
4. _____
5. _____
6. _____
7. _____
8. _____
9. _____
10. _____
11. _____
12. _____

1-10	90	80	70	60	50	40	30	20	10	0

Сравнение длины объектов

Имя: **Ключ к правильным ответам**

Расположите объекты от меньшего к большему.

1)

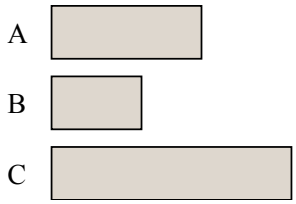

2)

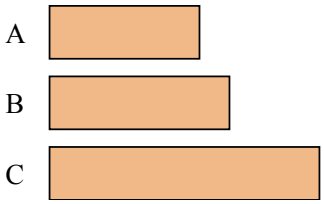

3)

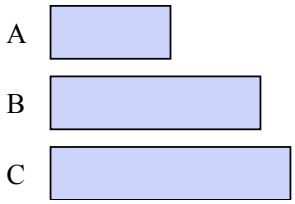

4)

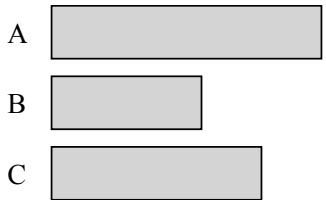

5)

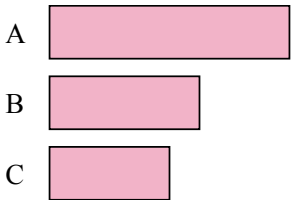

6)

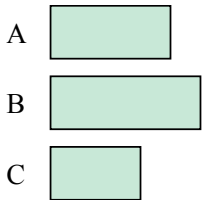

7)

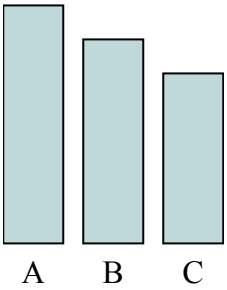

8)

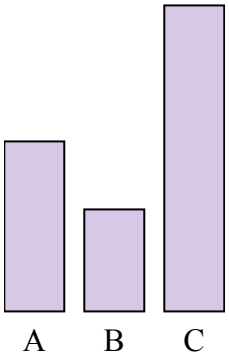

9)

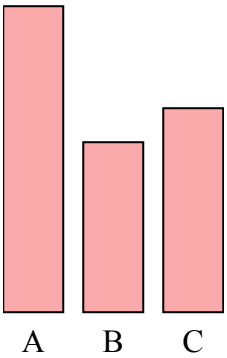

10)

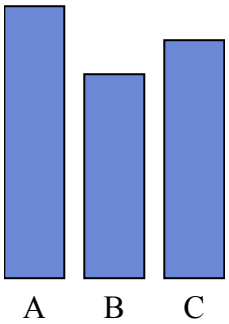

11)

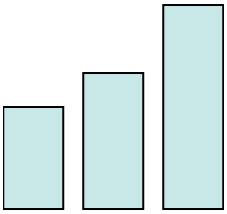

12)

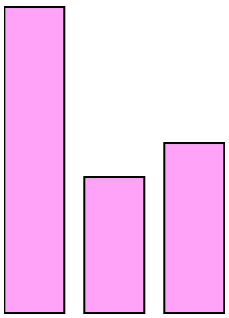

Ответы

1. **B, A, C**
2. **A, B, C**
3. **A, B, C**
4. **B, C, A**
5. **C, B, A**
6. **C, A, B**
7. **C, B, A**
8. **B, A, C**
9. **B, C, A**
10. **B, C, A**
11. **A, B, C**
12. **B, C, A**

1-10	90	80	70	60	50	40	30	20	10	0

Сравнение длины объектов Имя:

Расположите объекты от меньшего к большему.

1)

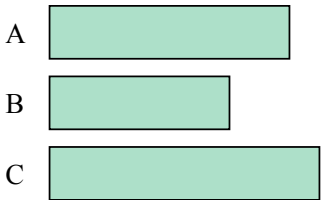

2)

3)

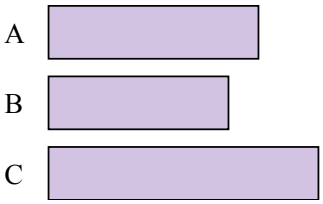

4)

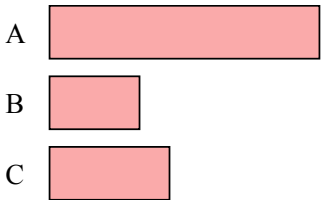

5)

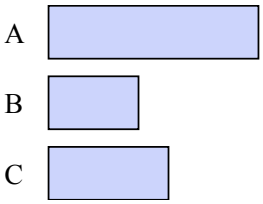

6)

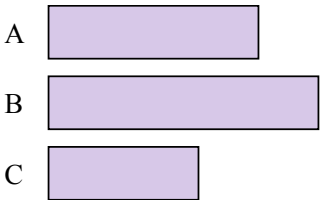

7)

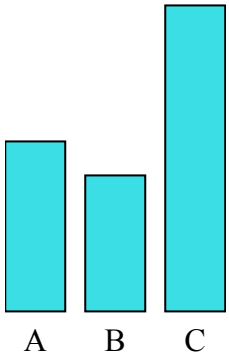

8)

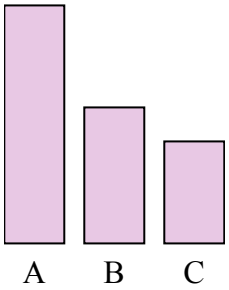

9)

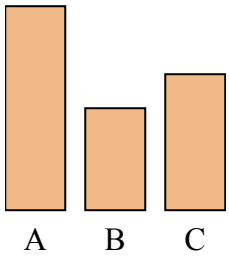

10)

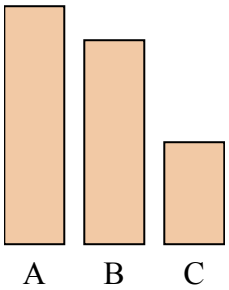

11)

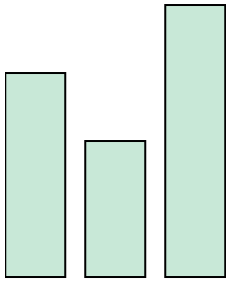

12)

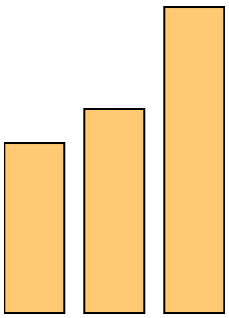

Ответы

1. _____
2. _____
3. _____
4. _____
5. _____
6. _____
7. _____
8. _____
9. _____
10. _____
11. _____
12. _____

1-10	90	80	70	60	50	40	30	20	10	0

Сравнение длины объектов

Имя: **Ключ к правильным ответам**

Расположите объекты от меньшего к большему.

1)

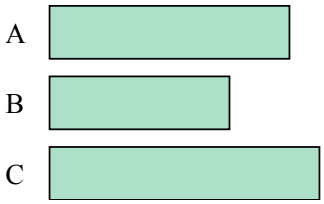

2)

3)

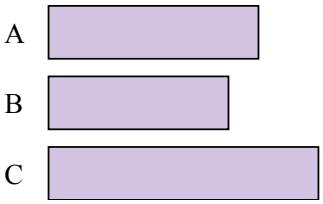

4)

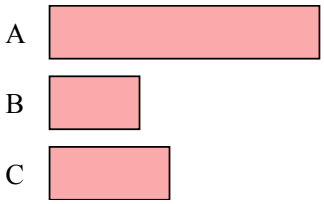

5)

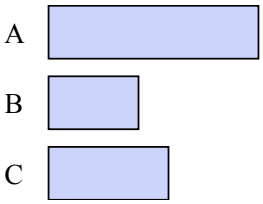

6)

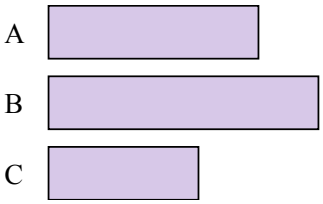

7)

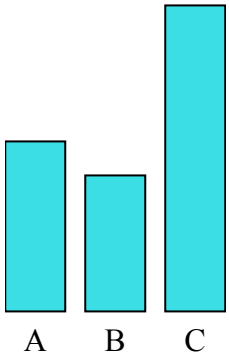

8)

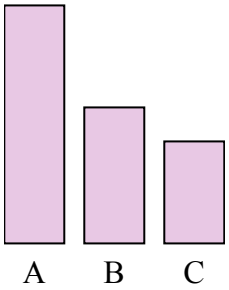

9)

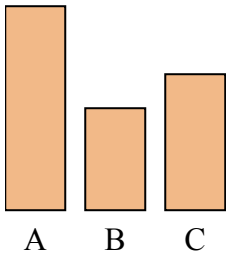

10)

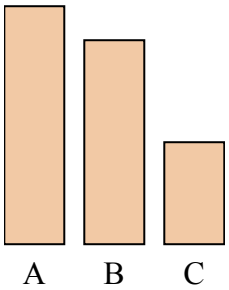

11)

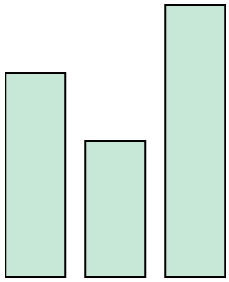

12)

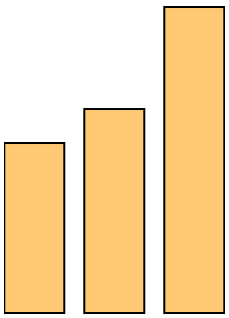

Ответы

1. **B, A, C**
2. **C, A, B**
3. **B, A, C**
4. **B, C, A**
5. **B, C, A**
6. **C, A, B**
7. **B, A, C**
8. **C, B, A**
9. **B, C, A**
10. **C, B, A**
11. **B, A, C**
12. **A, B, C**

1-10	90	80	70	60	50	40	30	20	10	0

Сравнение длины объектов Имя:

Расположите объекты от меньшего к большему.

1)

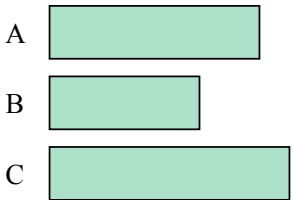

2)

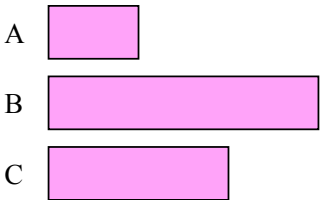

3)

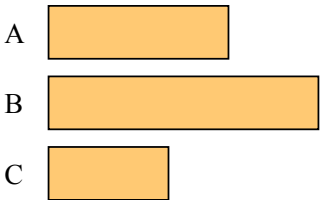

4)

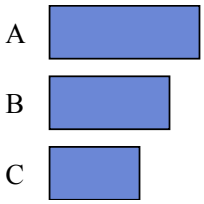

5)

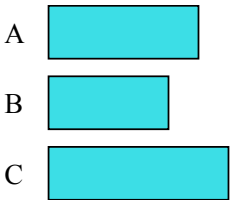

6)

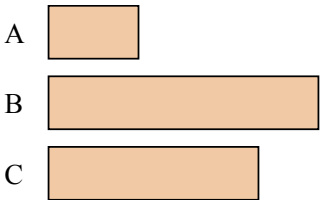

7)

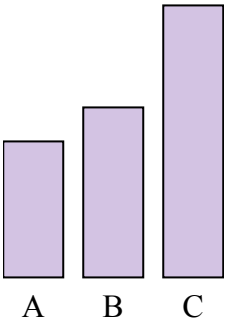

8)

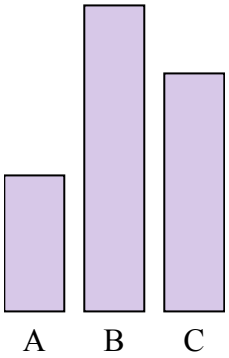

9)



10)

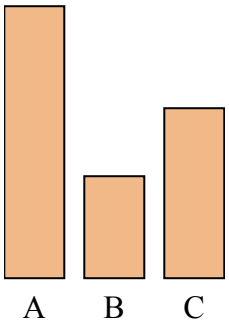

11)

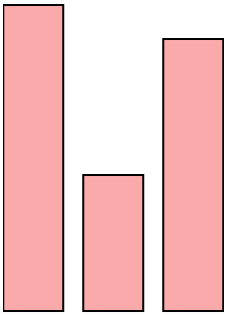

12)

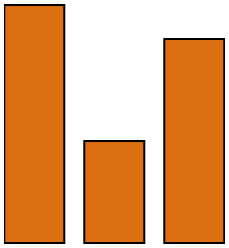

Ответы

1. _____
2. _____
3. _____
4. _____
5. _____
6. _____
7. _____
8. _____
9. _____
10. _____
11. _____
12. _____

1-10	90	80	70	60	50	40	30	20	10	0

Сравнение длины объектов

Имя: **Ключ к правильным ответам**

Расположите объекты от меньшего к большему.

1)

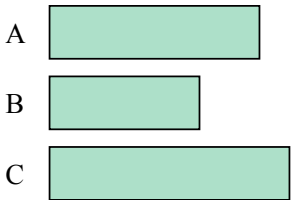

2)

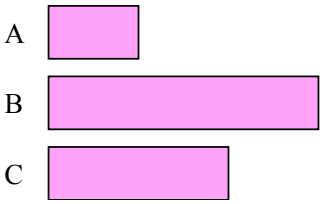

3)

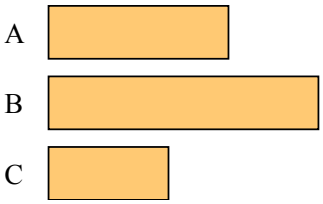

4)

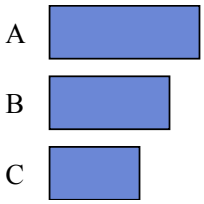

5)

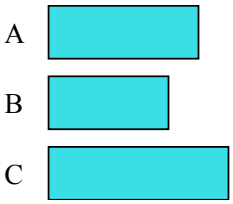

6)

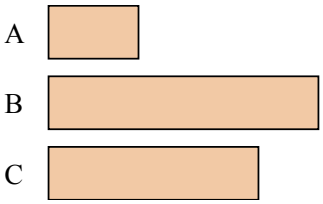

7)

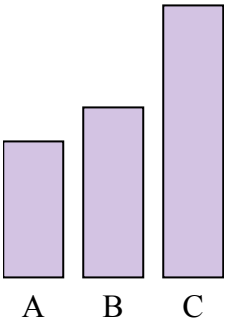

8)

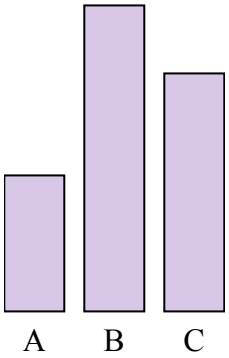

9)



10)

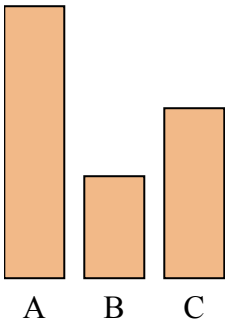

11)

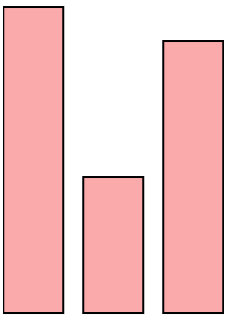

12)

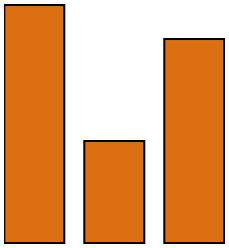

Ответы

1. **B, A, C**
2. **A, C, B**
3. **C, A, B**
4. **C, B, A**
5. **B, A, C**
6. **A, C, B**
7. **A, B, C**
8. **A, C, B**
9. **C, B, A**
10. **B, C, A**
11. **B, C, A**
12. **B, C, A**

1-10	90	80	70	60	50	40	30	20	10	0

Сравнение длины объектов Имя:

Расположите объекты от меньшего к большему.

1)



2)

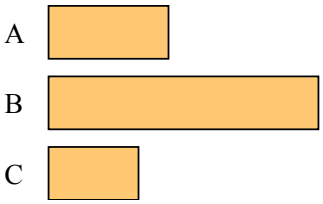

3)

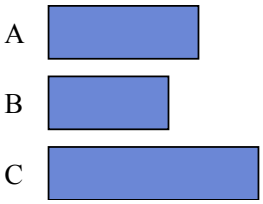

4)

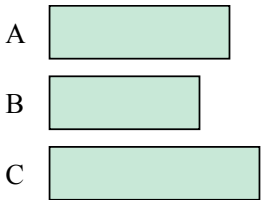

5)

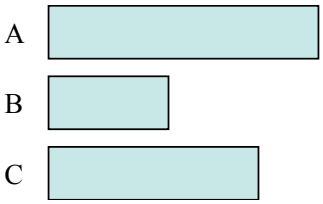

6)

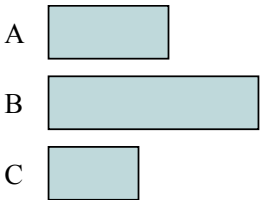

7)

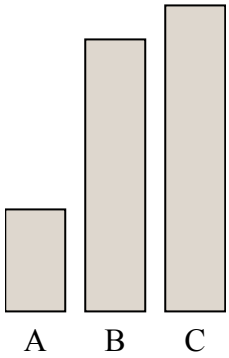

8)



9)

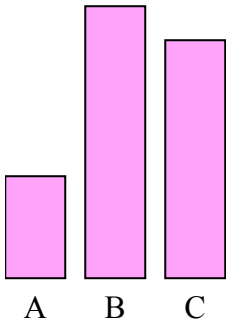

10)



11)

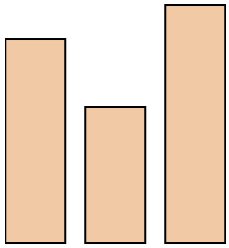

12)



Ответы

1. _____
2. _____
3. _____
4. _____
5. _____
6. _____
7. _____
8. _____
9. _____
10. _____
11. _____
12. _____

1-10	90	80	70	60	50	40	30	20	10	0

Сравнение длины объектов

Имя: **Ключ к правильным ответам**

Расположите объекты от меньшего к большему.

1)



2)

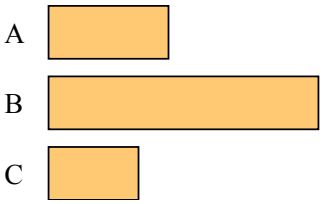

3)

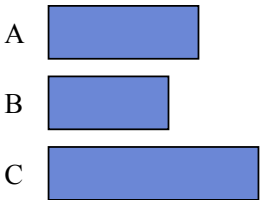

4)

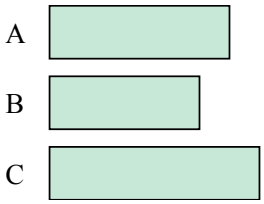

5)

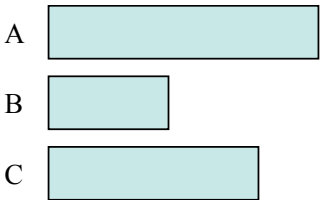

6)

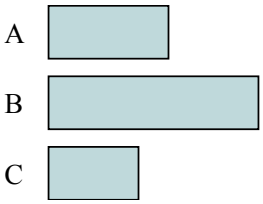

7)

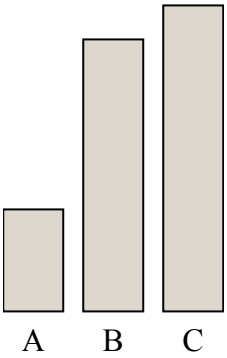

8)



9)

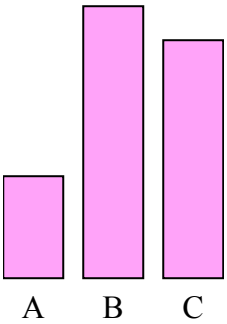

10)



11)

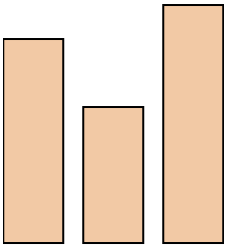

12)



Ответы

1. **C, B, A**
2. **C, A, B**
3. **B, A, C**
4. **B, A, C**
5. **B, C, A**
6. **C, A, B**
7. **A, B, C**
8. **C, B, A**
9. **A, C, B**
10. **A, C, B**
11. **B, A, C**
12. **A, B, C**

1-10	90	80	70	60	50	40	30	20	10	0