Расстояние между координатами Имя:

Определите расстояние между точками. Округлите ответ до десятков.

об)

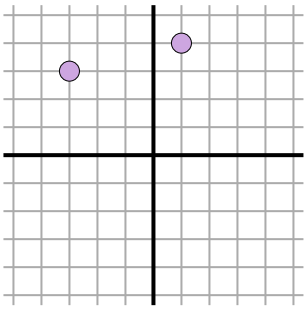

1)

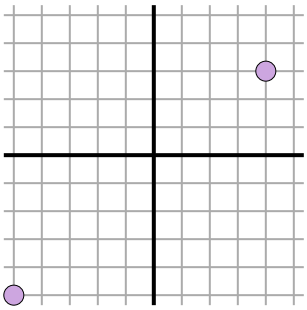

2)

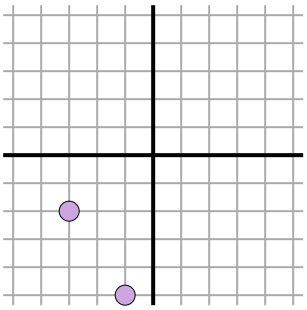

3)

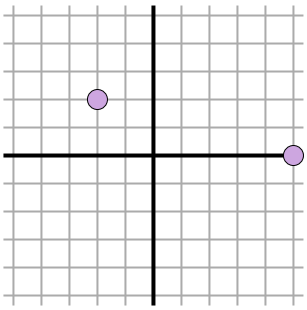

4)

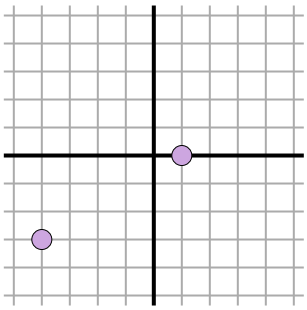

5)

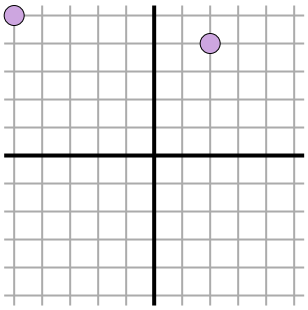

6)

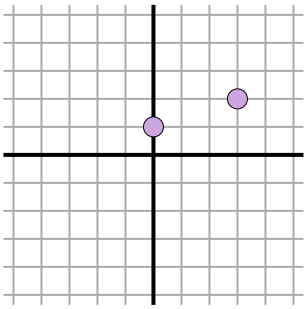

7)

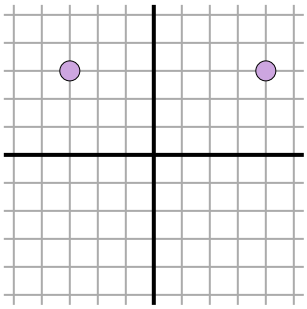

8)

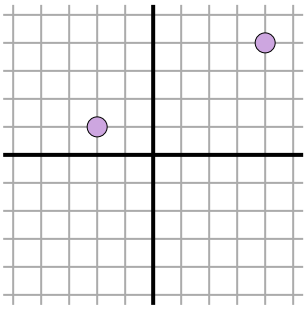

9)

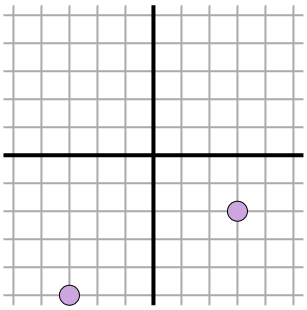

10)

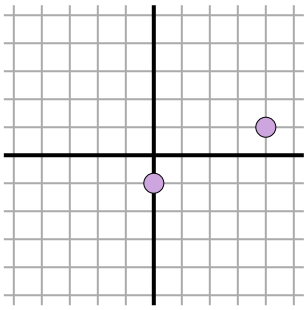

11)

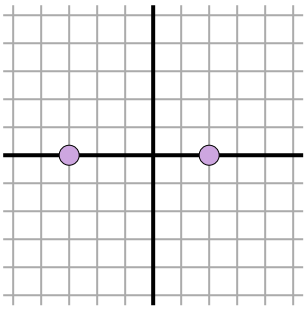

Ответы

об. 4,1

1. _____

2. _____

3. _____

4. _____

5. _____

6. _____

7. _____

8. _____

9. _____

10. _____

11. _____

1-10	91	82	73	64	55	45	36	27	18	9
11	0									

Расстояние между координатами Имя: Ключ к правильным ответам

Определите расстояние между точками. Округлите ответ до десятков.

об)

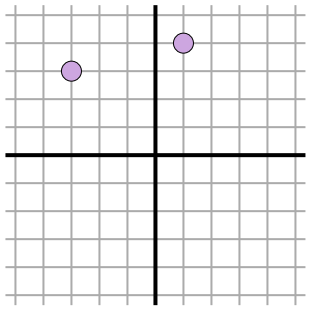

$\sqrt{(-3-1)^2 + (3-4)^2}$

$\sqrt{(16) + (1)}$

1)

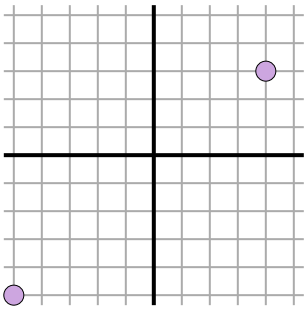

$\sqrt{(-5-4)^2 + (-5-3)^2}$

$\sqrt{(81) + (64)}$

2)

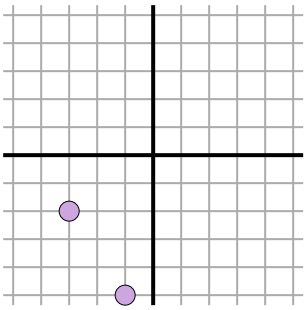

$\sqrt{(-3--1)^2 + (-2--5)^2}$

$\sqrt{(4) + (9)}$

3)

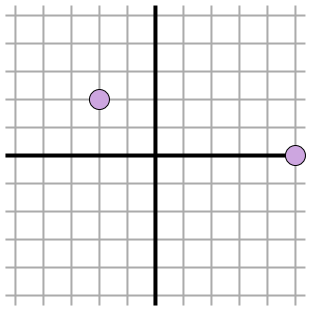

$\sqrt{(5--2)^2 + (0-2)^2}$

$\sqrt{(49) + (4)}$

4)

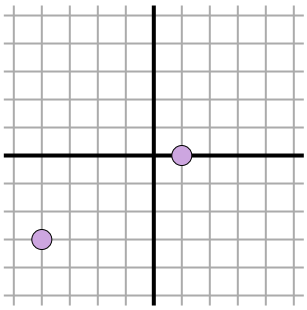

$\sqrt{(-4-1)^2 + (-3-0)^2}$

$\sqrt{(25) + (9)}$

5)

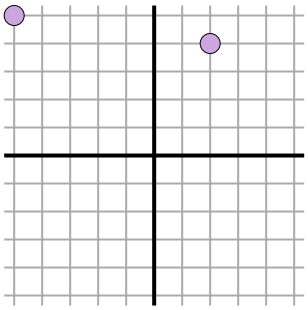

$\sqrt{(2--5)^2 + (4-5)^2}$

$\sqrt{(49) + (1)}$

6)

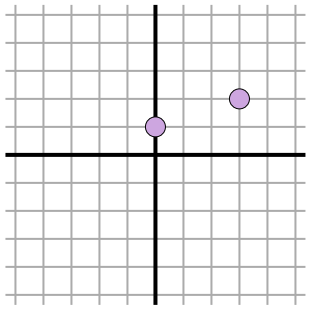

$\sqrt{(3-0)^2 + (2-1)^2}$

$\sqrt{(9) + (1)}$

7)

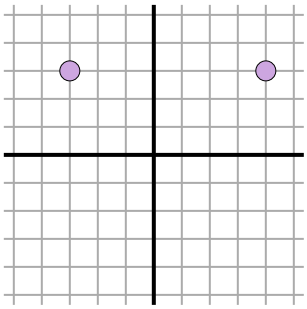

$\sqrt{(-3-4)^2 + (3-3)^2}$

$\sqrt{(49) + (0)}$

8)

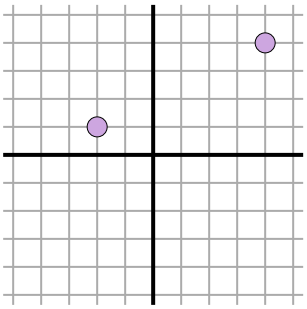

$\sqrt{(-2-4)^2 + (1-4)^2}$

$\sqrt{(36) + (9)}$

9)

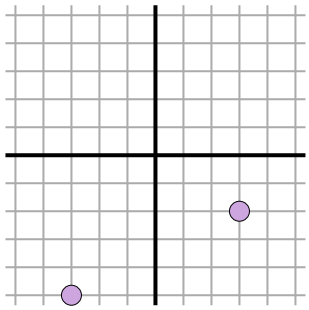

$\sqrt{(3--3)^2 + (-2--5)^2}$

$\sqrt{(36) + (9)}$

10)

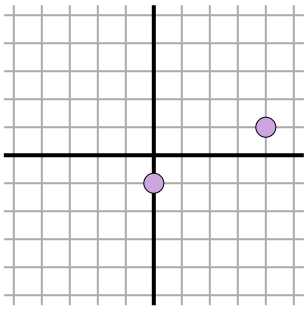

$\sqrt{(0-4)^2 + (-1-1)^2}$

$\sqrt{(16) + (4)}$

11)

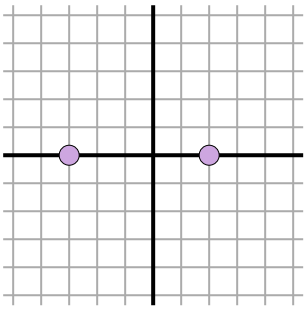

$\sqrt{(-3-2)^2 + (0-0)^2}$

$\sqrt{(25) + (0)}$

Ответы

об.	4,1
1.	12
2.	3,6
3.	7,3
4.	5,8
5.	7,1
6.	3,2
7.	7
8.	6,7
9.	6,7
10.	4,5
11.	5