Умножение дробей (визуальное) Имя:

Используйте поля с фигурами, показывающие примеры умножения.

об) $\frac{8}{9} \times \frac{1}{8} =$

1) $\frac{5}{6} \times \frac{5}{8} =$

2) $\frac{5}{6} \times \frac{2}{3} =$

3) $\frac{2}{3} \times \frac{3}{4} =$

4) $\frac{2}{3} \times \frac{6}{8} =$

5) $\frac{4}{5} \times \frac{1}{4} =$

6) $\frac{1}{4} \times \frac{2}{3} =$

7) $\frac{1}{4} \times \frac{3}{4} =$

8) $\frac{2}{4} \times \frac{1}{4} =$

9) $\frac{3}{7} \times \frac{1}{2} =$

10) $\frac{1}{4} \times \frac{1}{2} =$

11) $\frac{6}{7} \times \frac{3}{4} =$

Ответы

об. $^{8}/_{72}$

1. _____

2. _____

3. _____

4. _____

5. _____

6. _____

7. _____

8. _____

9. _____

10. _____

11. _____

1-10	91	82	73	64	55	45	36	27	18	9
11	0									

Умножение дробей (визуальное)

Имя: **Ключ к правильным ответам**

Используйте поля с фигурами, показывающие примеры умножения.

об) $\frac{8}{9} \times \frac{1}{8} =$

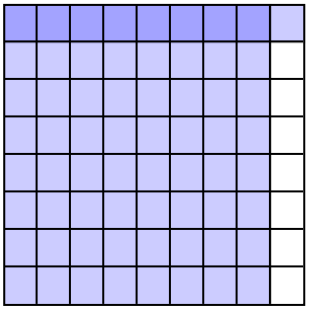

1) $\frac{5}{6} \times \frac{5}{8} =$

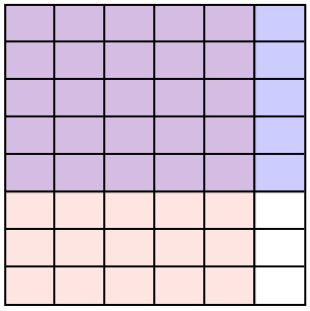

2) $\frac{5}{6} \times \frac{2}{3} =$

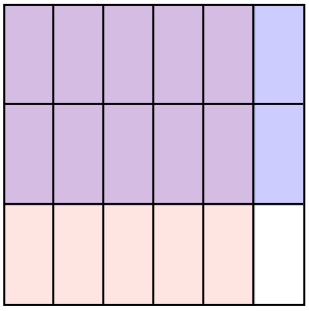

3) $\frac{2}{3} \times \frac{3}{4} =$



4) $\frac{2}{3} \times \frac{6}{8} =$

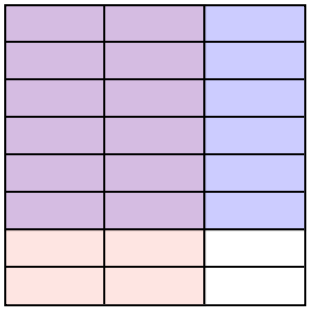

5) $\frac{4}{5} \times \frac{1}{4} =$

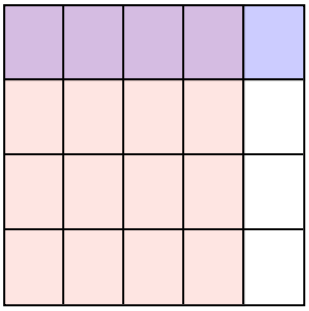

6) $\frac{1}{4} \times \frac{2}{3} =$



7) $\frac{1}{4} \times \frac{3}{4} =$



8) $\frac{2}{4} \times \frac{1}{4} =$



9) $\frac{3}{7} \times \frac{1}{2} =$

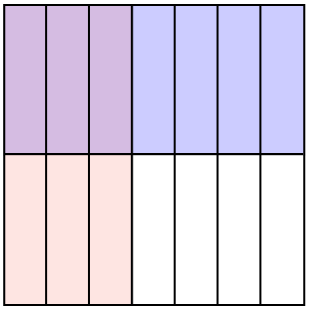

10) $\frac{1}{4} \times \frac{1}{2} =$



11) $\frac{6}{7} \times \frac{3}{4} =$

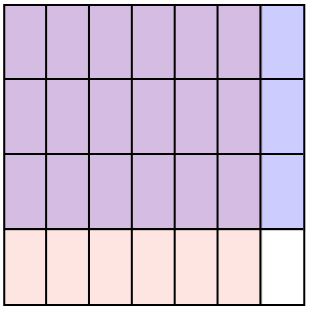

Ответы

об.	8/72
1.	25/48
2.	10/18
3.	6/12
4.	12/24
5.	4/20
6.	2/12
7.	3/16
8.	2/16
9.	3/14
10.	1/8
11.	18/28

1-10	91	82	73	64	55	45	36	27	18	9
11	0									