Неправильные и смешанные дроби визуально Имя:

Напишите каждый ряд фигур в виде смешанного числа.

1) 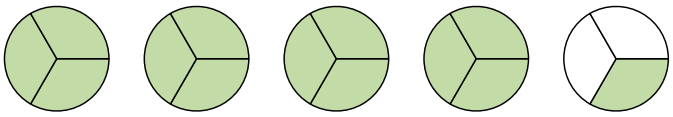

2) 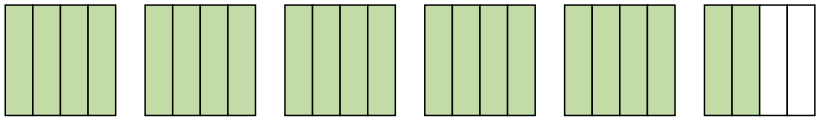

3) 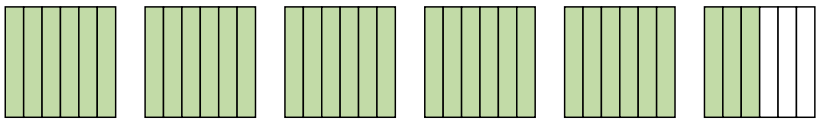

4) 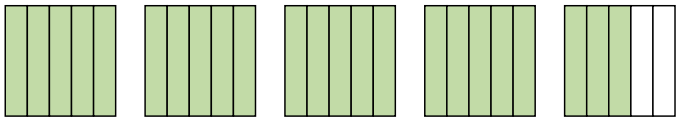

5) 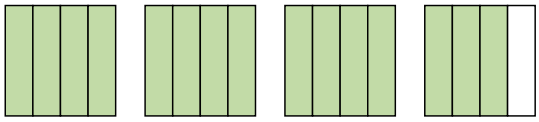

Напишите каждое число в виде неправильной дроби.

6) 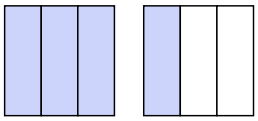

7) 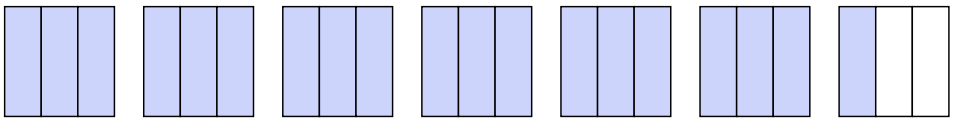

8) 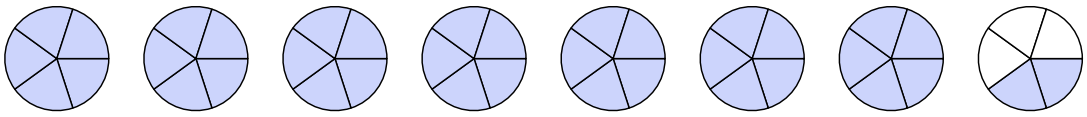

9) 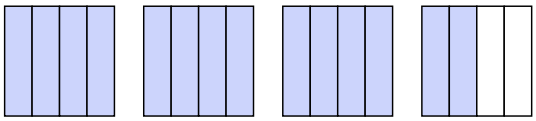

10) 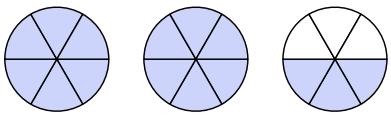

11) 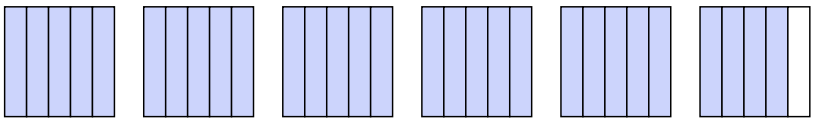

Ответы

1. _____
2. _____
3. _____
4. _____
5. _____
6. _____
7. _____
8. _____
9. _____
10. _____
11. _____

1-10	91	82	73	64	55	45	36	27	18	9
11	0									

Напишите каждый ряд фигур в виде смешанного числа.

1) 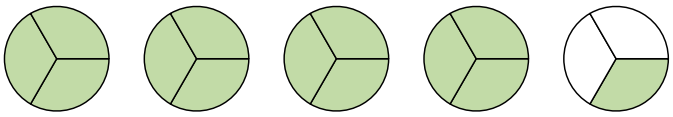

2) 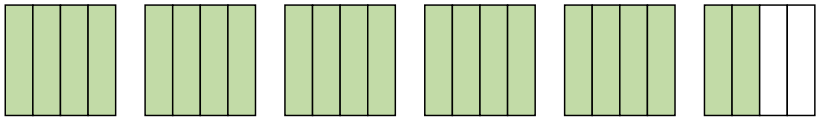

3) 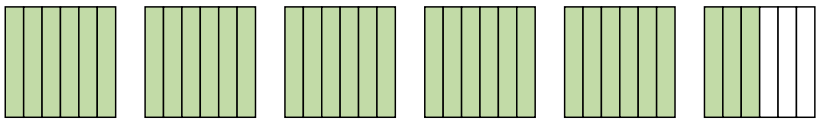

4) 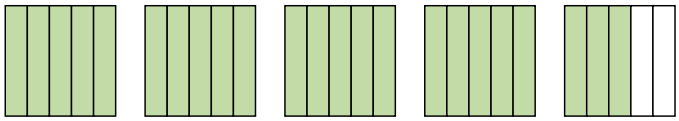

5) 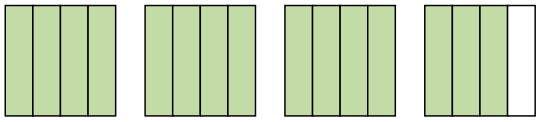

Напишите каждое число в виде неправильной дроби.

6) 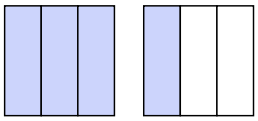

7) 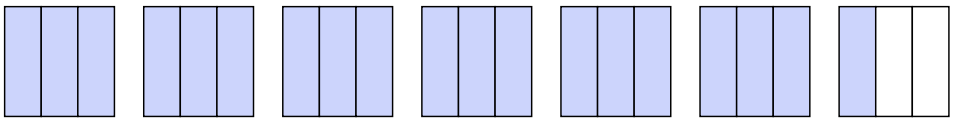

8) 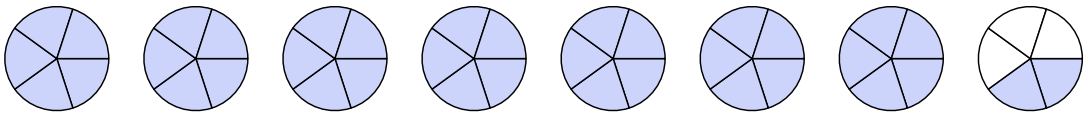

9) 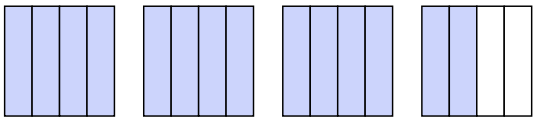

10) 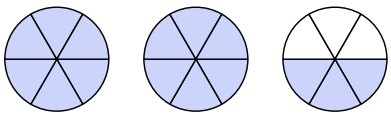

11) 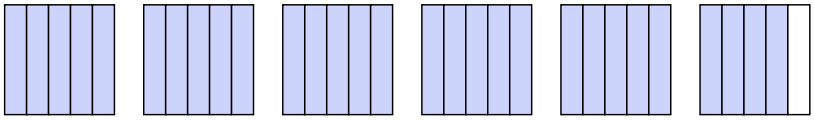

Ответы

1. $4\frac{1}{3}$
2. $5\frac{2}{4}$
3. $5\frac{3}{6}$
4. $4\frac{3}{5}$
5. $3\frac{3}{4}$
6. $\frac{4}{3}$
7. $\frac{19}{3}$
8. $\frac{37}{5}$
9. $\frac{14}{4}$
10. $\frac{15}{6}$
11. $\frac{29}{5}$

1-10	91	82	73	64	55	45	36	27	18	9
11	0									