Отметьте каждое местоположение.

1) Отметьте положение $3\frac{1}{4}$

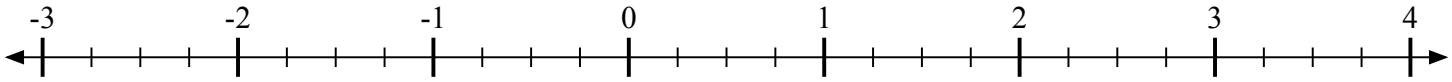

2) Отметьте положение $-1\frac{1}{2}$

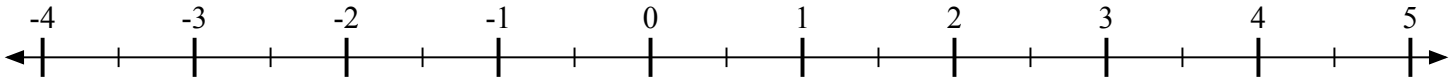

3) Отметьте положение $1\frac{1}{8}$

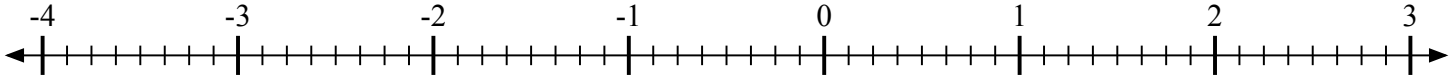

4) Отметьте положение $-1\frac{2}{4}$

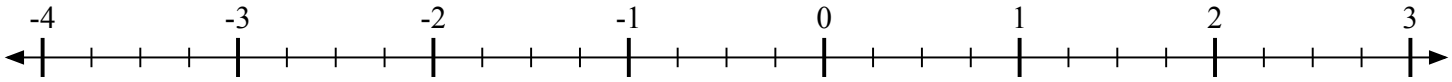

5) Отметьте положение $-2\frac{2}{6}$

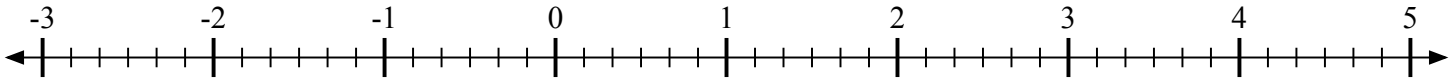

6) Отметьте положение $-1\frac{3}{6}$

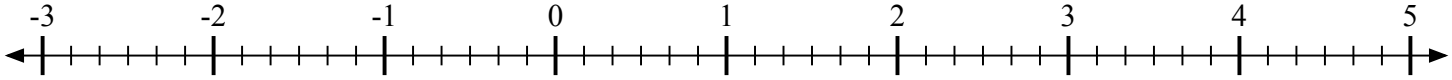

7) Отметьте положение $-1\frac{1}{4}$

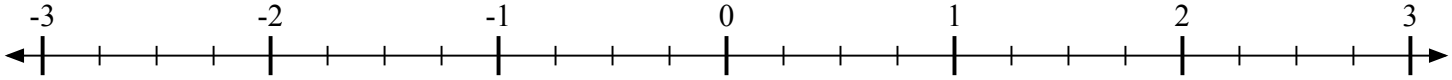

8) Отметьте положение $-4\frac{2}{3}$

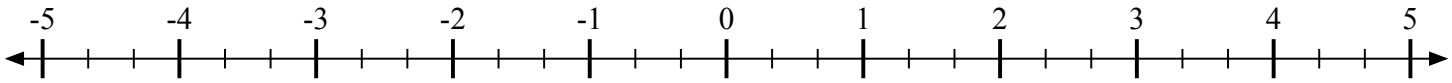

9) Отметьте положение $-2\frac{5}{8}$

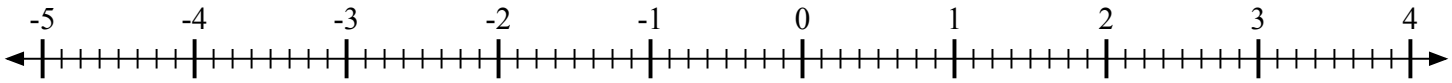

1-9	89	78	67	56	44	33	22	11	0

Отметьте каждое местоположение.

1) Отметьте положение $3\frac{1}{4}$

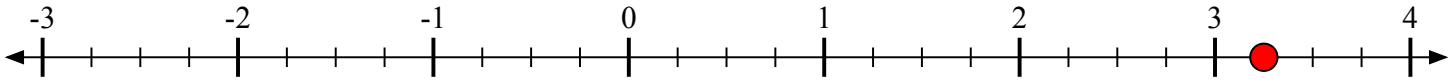

2) Отметьте положение $-1\frac{1}{2}$

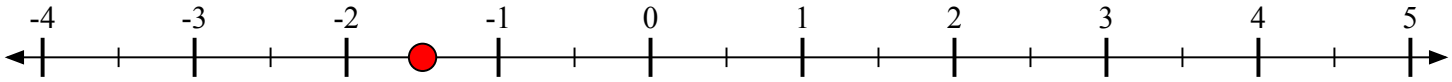

3) Отметьте положение $1\frac{1}{8}$

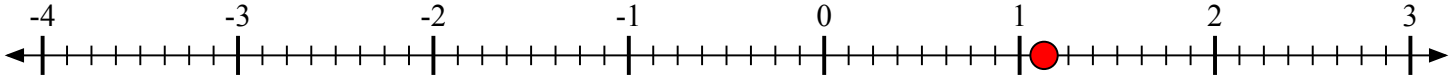

4) Отметьте положение $-1\frac{2}{4}$

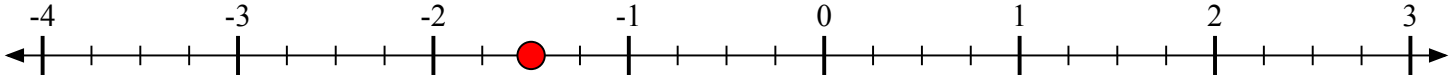

5) Отметьте положение $-2\frac{2}{6}$

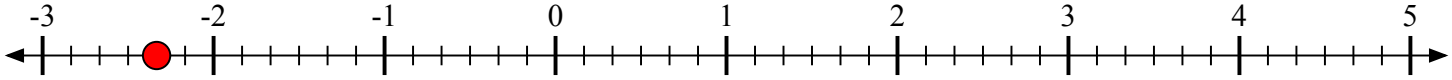

6) Отметьте положение $-1\frac{3}{6}$

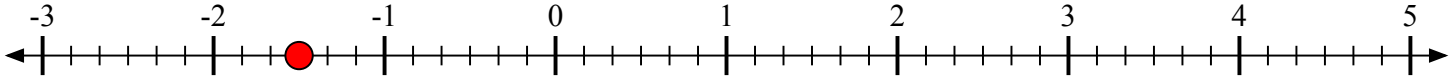

7) Отметьте положение $-1\frac{1}{4}$

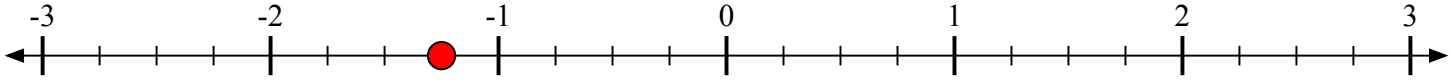

8) Отметьте положение $-4\frac{2}{3}$

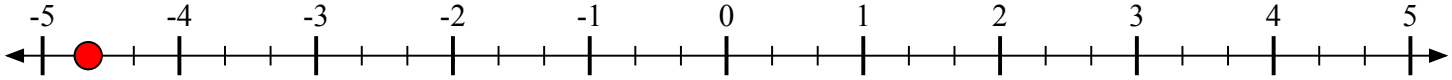

9) Отметьте положение $-2\frac{5}{8}$

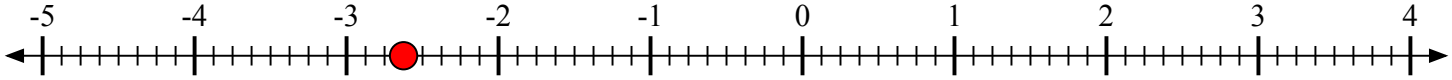

1-9	89	78	67	56	44	33	22	11	0