Нахождение дроби(визуальное) Имя:

Определите под какой буквой находятся соответствующие дроби.

1)



$\frac{10}{20}$

2)

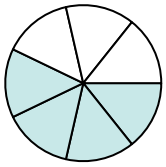

$\frac{4}{7}$

3)

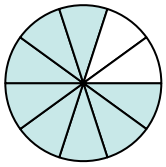

$\frac{8}{10}$

4)

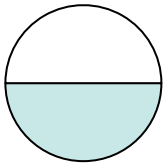

$\frac{1}{2}$

5)

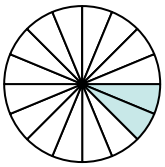

$\frac{2}{16}$

6)

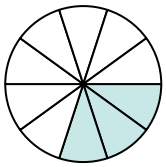

$\frac{3}{10}$

7)

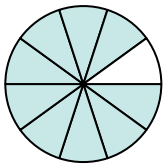

$\frac{9}{10}$

8)

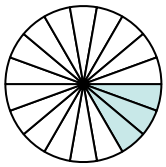

$\frac{3}{18}$

9)

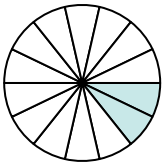

$\frac{2}{14}$

10)

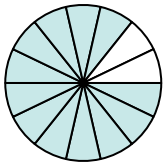

$\frac{12}{14}$

11)

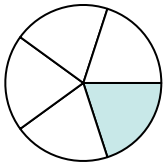

$\frac{1}{5}$

12)

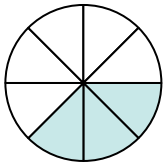

$\frac{3}{8}$

A.

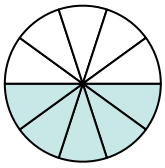

$\frac{5}{10}$

B.

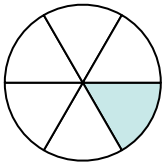

$\frac{1}{6}$

C.

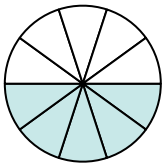

$\frac{5}{10}$

D.

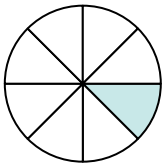

$\frac{1}{8}$

E.

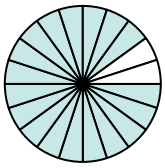

$\frac{18}{20}$

F.

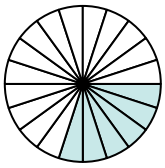

$\frac{6}{20}$

G.

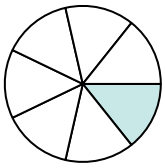

$\frac{1}{7}$

H.

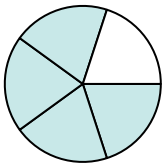

$\frac{4}{5}$

I.

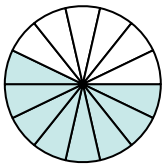

$\frac{8}{14}$

J.

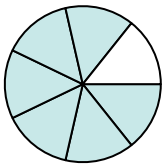

$\frac{6}{7}$

K.

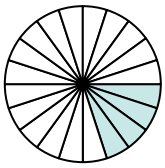

$\frac{4}{20}$

L.

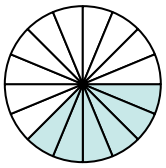

$\frac{6}{16}$

Ответы

1. _____
2. _____
3. _____
4. _____
5. _____
6. _____
7. _____
8. _____
9. _____
10. _____
11. _____
12. _____

1-10	92	83	75	67	58	50	42	33	25	17
11-12	8	0								

Нахождение дроби(визуальное) Имя: Ключ к правильным ответам

Определите под какой буквой находятся соответствующие дроби.

1)



$\frac{10}{20}$

2)

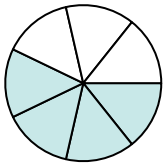

$\frac{4}{7}$

3)

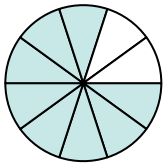

$\frac{8}{10}$

4)

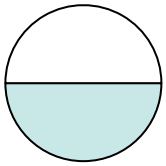

$\frac{1}{2}$

5)

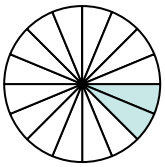

$\frac{2}{16}$

6)

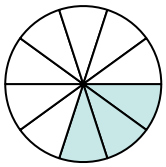

$\frac{3}{10}$

7)

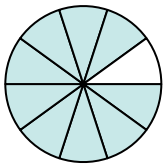

$\frac{9}{10}$

8)

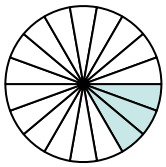

$\frac{3}{18}$

9)

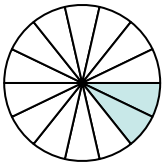

$\frac{2}{14}$

10)

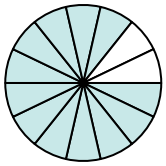

$\frac{12}{14}$

11)

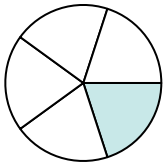

$\frac{1}{5}$

12)

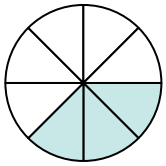

$\frac{3}{8}$

A.

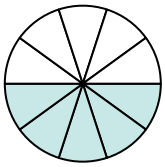

$\frac{5}{10}$

B.

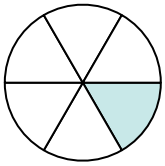

$\frac{1}{6}$

C.

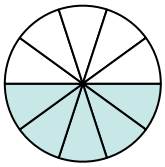

$\frac{5}{10}$

D.

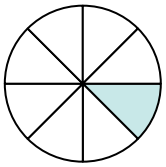

$\frac{1}{8}$

E.

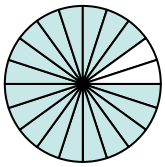

$\frac{18}{20}$

F.



$\frac{6}{20}$

G.

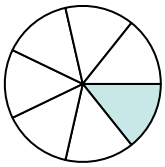

$\frac{1}{7}$

H.

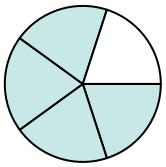

$\frac{4}{5}$

I.

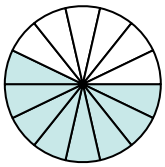

$\frac{8}{14}$

J.

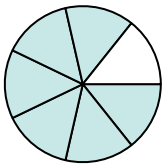

$\frac{6}{7}$

K.



$\frac{4}{20}$

L.

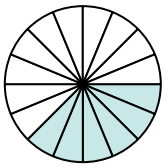

$\frac{6}{16}$

Ответы

1. C
2. I
3. H
4. A
5. D
6. F
7. E
8. B
9. G
10. J
11. K
12. L

1-10	92	83	75	67	58	50	42	33	25	17
11-12	8	0								