Деление единиц и дробей (Визуальное) Имя:

Используйте данное поле с примером, как разделить дробь и целое число.

$\frac{1}{3} \div 4 = ?$



Para resolverlo, comience con un todo.

Divida el conjunto en 3 piezas y complete 1 sección.

Ahora puedes ver el tamaño de $\frac{1}{3}$

Em seguida, divida a $\frac{1}{3}$ em 4 grupos.

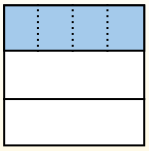

Esto muestra el tamaño de cada pieza.

Para calcular el tamaño de cada pieza en comparación con el conjunto, divida el conjunto en 4 grupos.

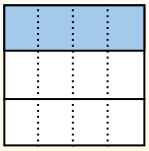

Each piece is $\frac{1}{12}$ of the whole.
Or:
$\frac{1}{3} \div 4 = \frac{1}{12}$

1) $\frac{1}{8}:8 =$

2) $\frac{1}{7}:3 =$

3) $\frac{1}{7}:2 =$

4) $\frac{1}{7}:8 =$

5) $\frac{1}{6}:2 =$

6) $\frac{1}{5}:5 =$

7) $\frac{1}{2}:2 =$

8) $\frac{1}{8}:4 =$

9) $\frac{1}{7}:5 =$

10) $\frac{1}{6}:3 =$

11) $\frac{1}{6}:4 =$

12) $\frac{1}{3}:7 =$

Ответы

1. _____
2. _____
3. _____
4. _____
5. _____
6. _____
7. _____
8. _____
9. _____
10. _____
11. _____
12. _____

1-10	92	83	75	67	58	50	42	33	25	17
11-12	8	0								

Деление единиц и дробей (Визуальное)

Имя: **Ключ к правильным ответам**

Используйте данное поле с примером, как разделить дробь и целое число.

$\frac{1}{3} \div 4 = ?$



Para resolverlo, comience con un todo.

Divida el conjunto en 3 piezas y complete 1 sección.

Ahora puedes ver el tamaño de $\frac{1}{3}$

Em seguida, divida a $\frac{1}{3}$ em 4 grupos.

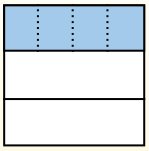

Esto muestra el tamaño de cada pieza.

Para calcular el tamaño de cada pieza en comparación con el conjunto, divida el conjunto en 4 grupos.

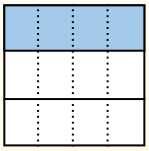

Each piece is $\frac{1}{12}$ of the whole.
Or:
$\frac{1}{3} \div 4 = \frac{1}{12}$

1) $\frac{1}{8}:8 =$

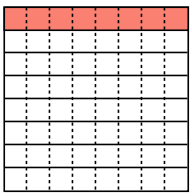

2) $\frac{1}{7}:3 =$

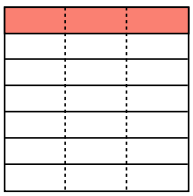

3) $\frac{1}{7}:2 =$

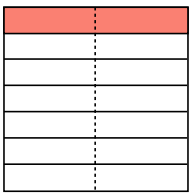

4) $\frac{1}{7}:8 =$

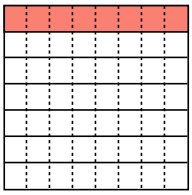

5) $\frac{1}{6}:2 =$

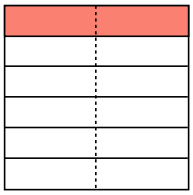

6) $\frac{1}{5}:5 =$

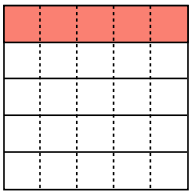

7) $\frac{1}{2}:2 =$

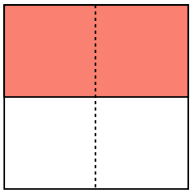

8) $\frac{1}{8}:4 =$

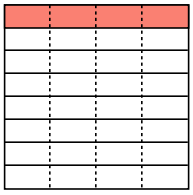

9) $\frac{1}{7}:5 =$

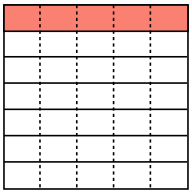

10) $\frac{1}{6}:3 =$

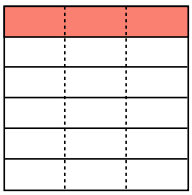

11) $\frac{1}{6}:4 =$

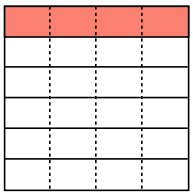

12) $\frac{1}{3}:7 =$

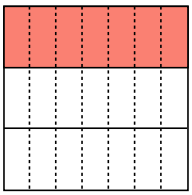

Ответы

1. $\frac{1}{64}$
2. $\frac{1}{21}$
3. $\frac{1}{14}$
4. $\frac{1}{56}$
5. $\frac{1}{12}$
6. $\frac{1}{25}$
7. $\frac{1}{4}$
8. $\frac{1}{32}$
9. $\frac{1}{35}$
10. $\frac{1}{18}$
11. $\frac{1}{24}$
12. $\frac{1}{21}$

1-10	92	83	75	67	58	50	42	33	25	17
11-12	8	0								