Используйте числовую прямую для решения задачи.

1) $2 : \frac{2}{3}$

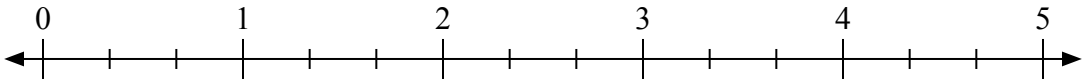

2) $2 : \frac{1}{3}$



3) $4 : \frac{3}{8}$

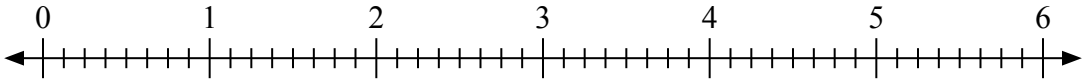

4) $6 : \frac{8}{9}$

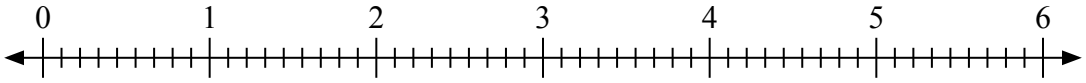

5) $2 : \frac{1}{2}$

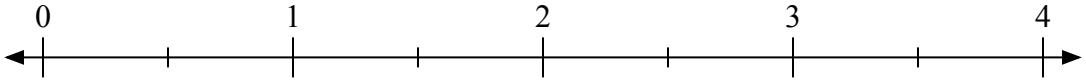

6) $3 : \frac{8}{9}$

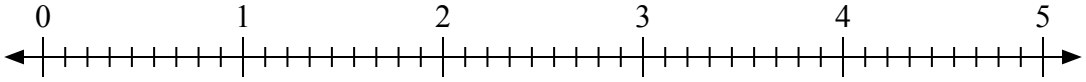

7) $2 : \frac{3}{6}$

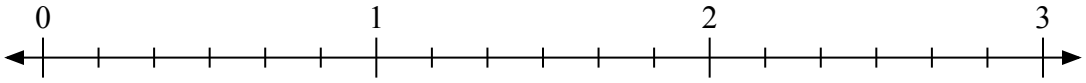

8) $2 : \frac{4}{6}$

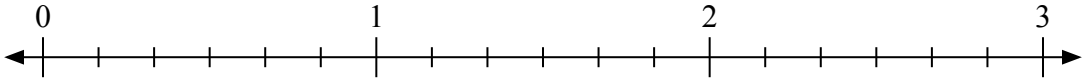

9) $3 : \frac{5}{6}$

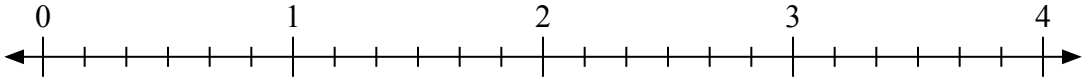

Ответы

1. _____
2. _____
3. _____
4. _____
5. _____
6. _____
7. _____
8. _____
9. _____

1-9	89	78	67	56	44	33	22	11	0

Используйте числовую прямую для решения задачи.

1) $2 : \frac{2}{3}$

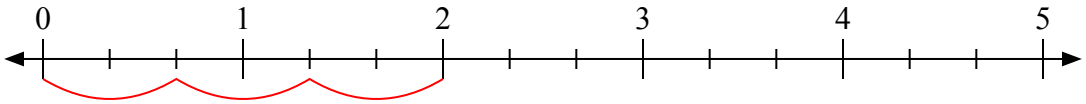

2) $2 : \frac{1}{3}$

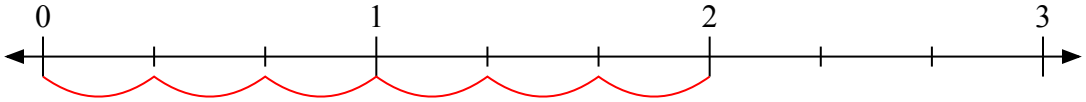

3) $4 : \frac{3}{8}$

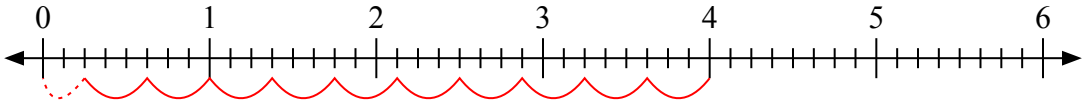

4) $6 : \frac{8}{9}$

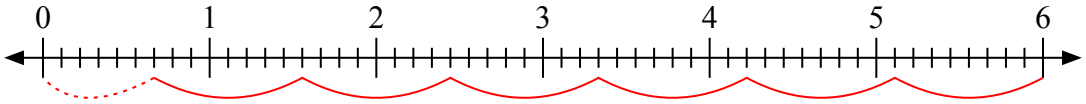

5) $2 : \frac{1}{2}$

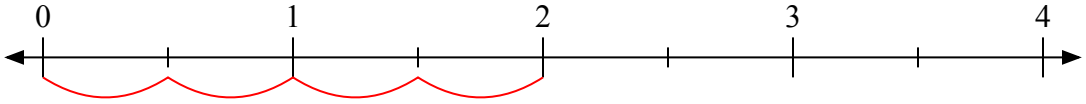

6) $3 : \frac{8}{9}$

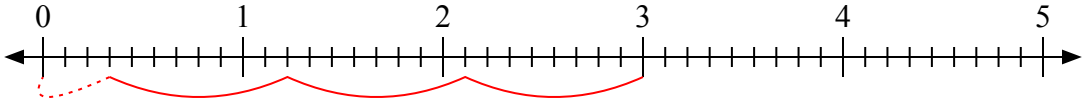

7) $2 : \frac{3}{6}$

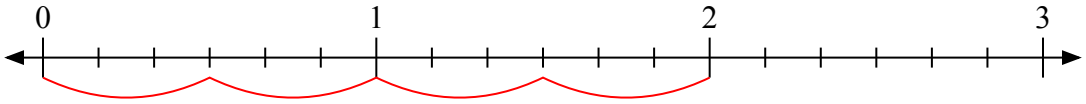

8) $2 : \frac{4}{6}$

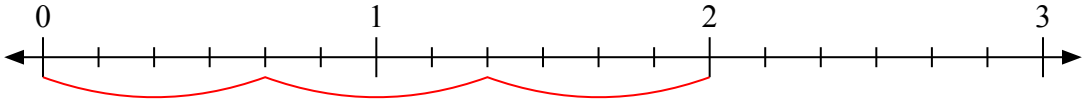

9) $3 : \frac{5}{6}$

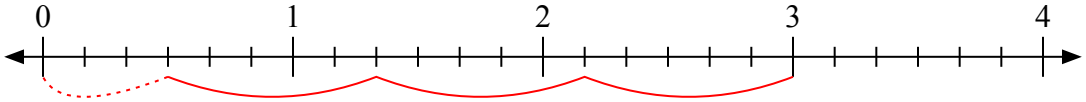

Ответы

1. **3**
2. **6**
3. **$10\frac{2}{3}$**
4. **$6\frac{6}{8}$**
5. **4**
6. **$3\frac{3}{8}$**
7. **4**
8. **3**
9. **$3\frac{3}{5}$**

1-9	89	78	67	56	44	33	22	11	0