Используйте числовую прямую для решения задачи.

1) $5 : \frac{1}{2}$

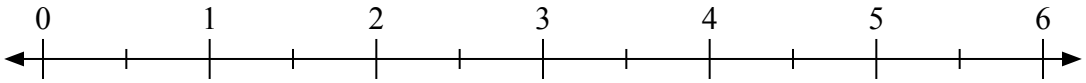

2) $4 : \frac{4}{7}$

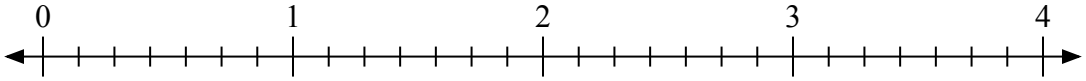

3) $3 : \frac{1}{5}$

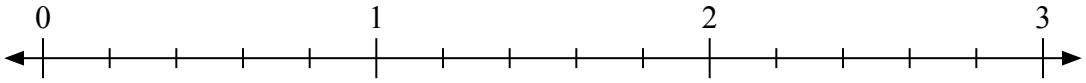

4) $2 : \frac{2}{5}$

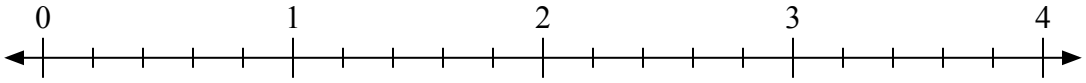

5) $2 : \frac{1}{2}$

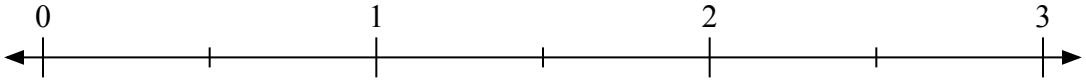

6) $3 : \frac{2}{3}$

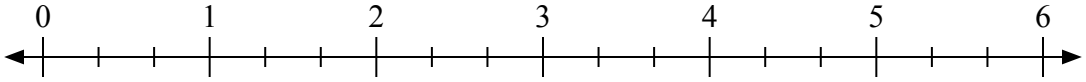

7) $2 : \frac{2}{7}$

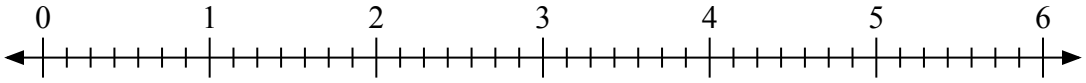

8) $2 : \frac{4}{9}$

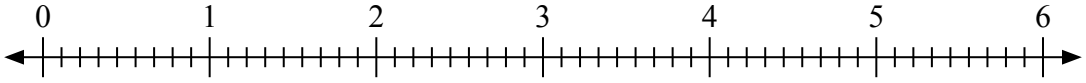

9) $3 : \frac{1}{2}$

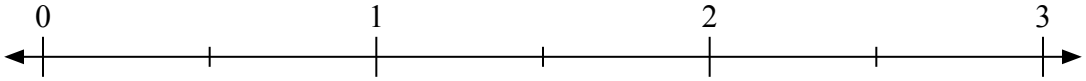

Ответы

1. _____
2. _____
3. _____
4. _____
5. _____
6. _____
7. _____
8. _____
9. _____

1-9	89	78	67	56	44	33	22	11	0

Используйте числовую прямую для решения задачи.

1) $5 : \frac{1}{2}$

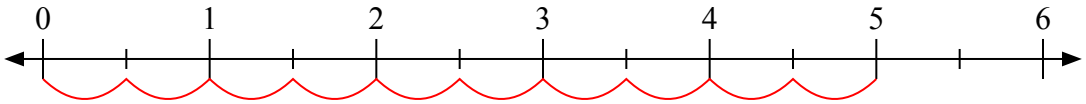

2) $4 : \frac{4}{7}$

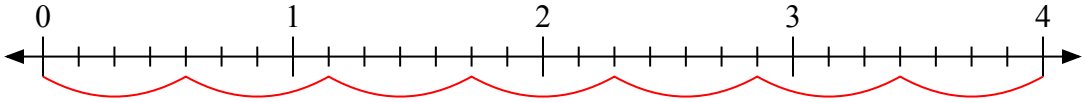

3) $3 : \frac{1}{5}$

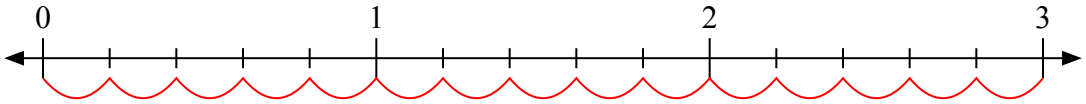

4) $2 : \frac{2}{5}$

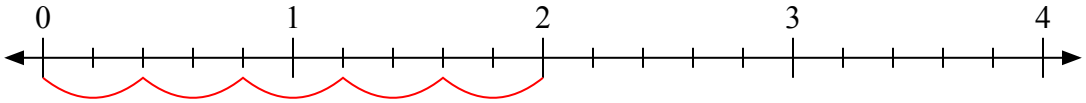

5) $2 : \frac{1}{2}$

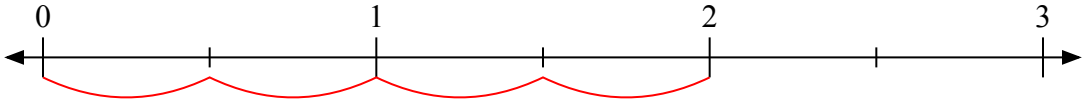

6) $3 : \frac{2}{3}$

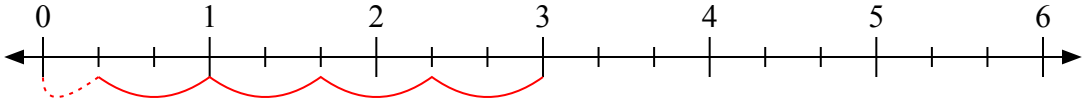

7) $2 : \frac{2}{7}$

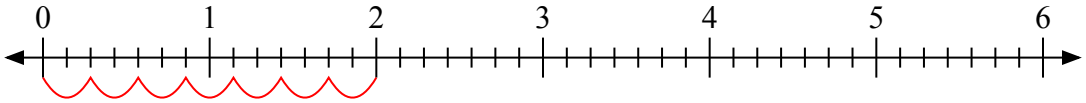

8) $2 : \frac{4}{9}$

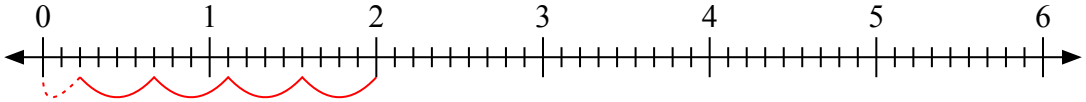

9) $3 : \frac{1}{2}$

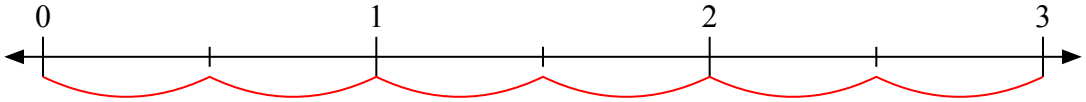

Ответы

1. **10**
2. **7**
3. **15**
4. **5**
5. **4**
6. **$4\frac{1}{2}$**
7. **7**
8. **$4\frac{2}{4}$**
9. **6**

1-9	89	78	67	56	44	33	22	11	0