Используйте числовую прямую для решения задачи.

1) $2 : \frac{1}{8}$

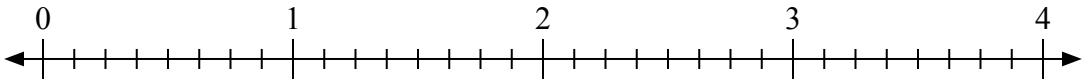

2) $2 : \frac{2}{3}$

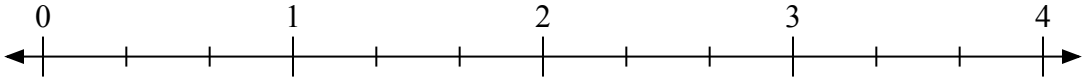

3) $2 : \frac{1}{2}$

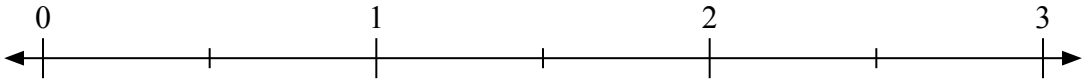

4) $3 : \frac{5}{8}$

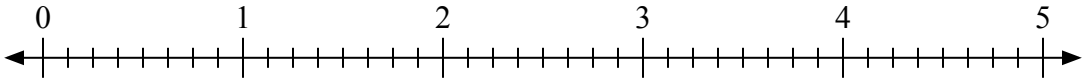

5) $2 : \frac{6}{7}$

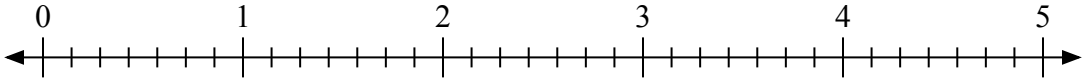

6) $4 : \frac{1}{3}$

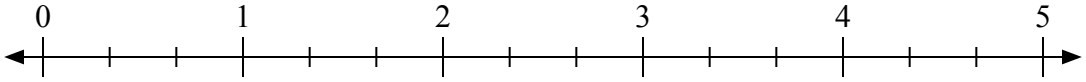

7) $2 : \frac{3}{8}$

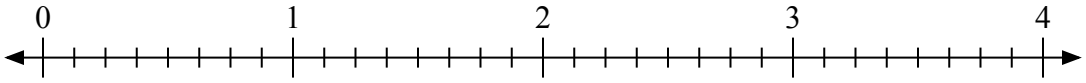

8) $2 : \frac{2}{8}$

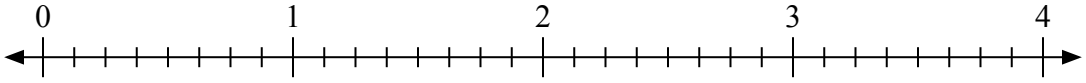

9) $2 : \frac{3}{5}$

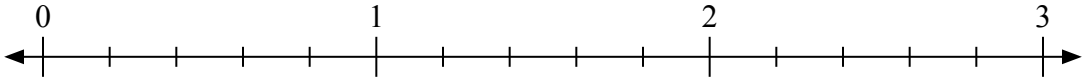

Ответы

1. _____
2. _____
3. _____
4. _____
5. _____
6. _____
7. _____
8. _____
9. _____

1-9	89	78	67	56	44	33	22	11	0

Используйте числовую прямую для решения задачи.

1) $2 : \frac{1}{8}$

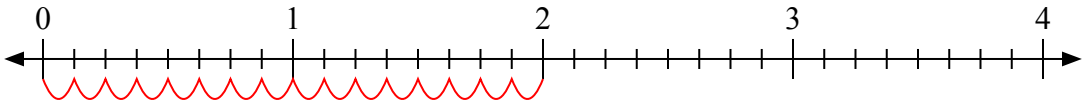

2) $2 : \frac{2}{3}$

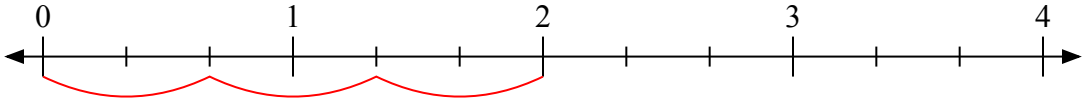

3) $2 : \frac{1}{2}$

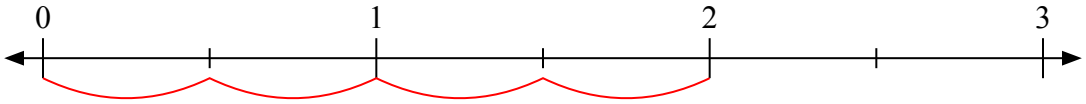

4) $3 : \frac{5}{8}$

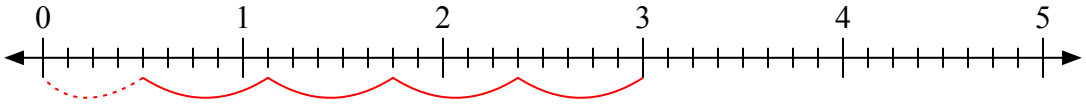

5) $2 : \frac{6}{7}$

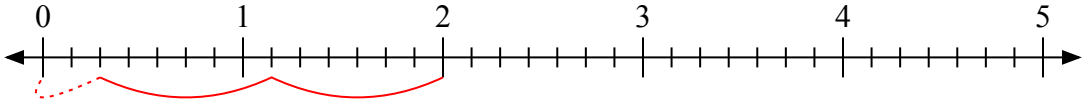

6) $4 : \frac{1}{3}$

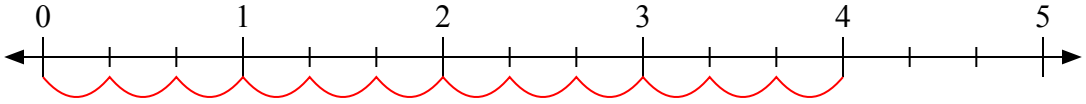

7) $2 : \frac{3}{8}$

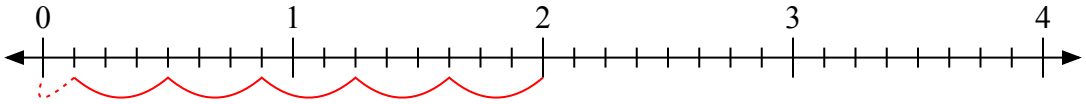

8) $2 : \frac{2}{8}$

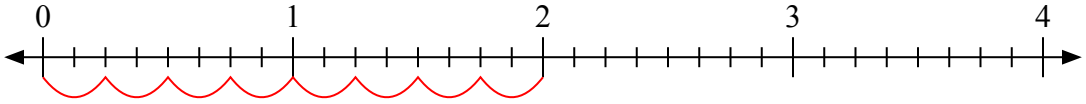

9) $2 : \frac{3}{5}$

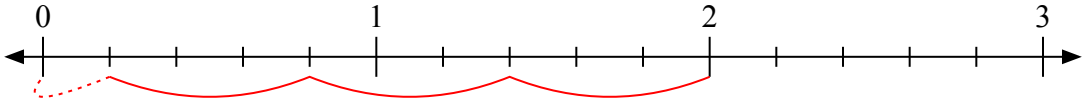

Ответы

1. **16**
2. **3**
3. **4**
4. **$4\frac{4}{5}$**
5. **$2\frac{2}{6}$**
6. **12**
7. **$5\frac{1}{3}$**
8. **8**
9. **$3\frac{1}{3}$**

1-9	89	78	67	56	44	33	22	11	0