Значение десятичных дробей(визуальное) Имя:

Определите часть закрашенного к целому. Напишите ответ в десятичной дроби.

1) 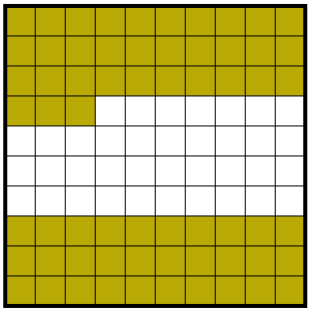

2) 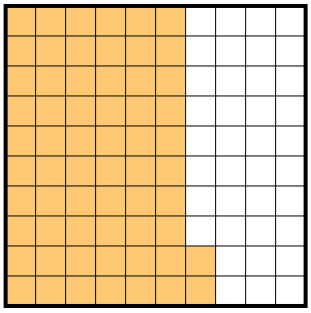

3) 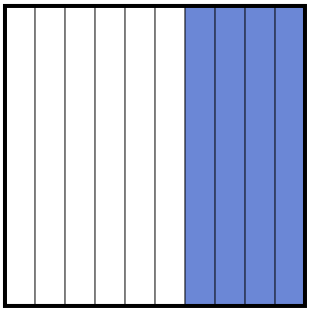

4) 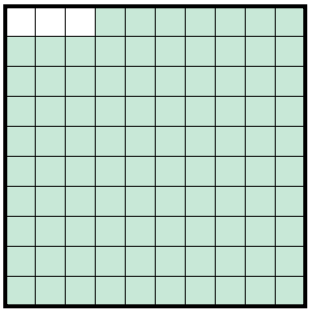

5) 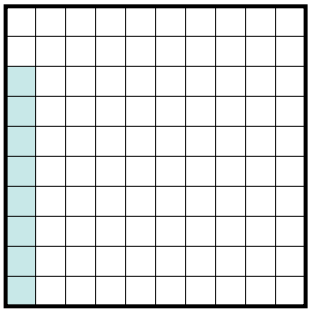

6) 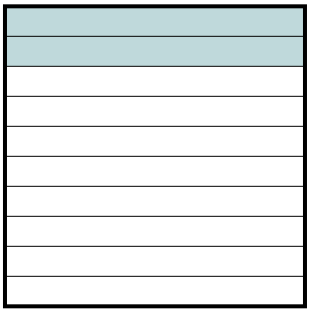

7) 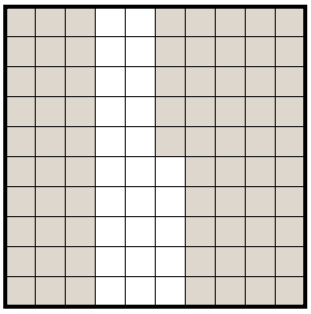

8) 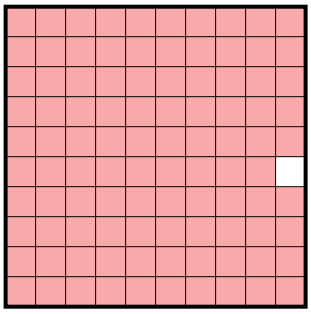

9) 

10) 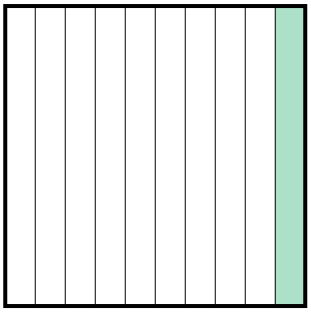

11) 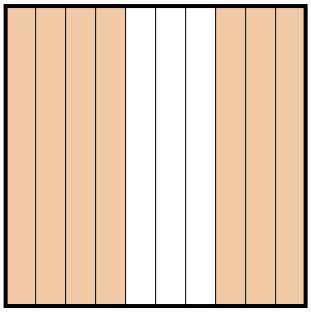

12) 

Ответы

1. _____
2. _____
3. _____
4. _____
5. _____
6. _____
7. _____
8. _____
9. _____
10. _____
11. _____
12. _____

1-10	92	83	75	67	58	50	42	33	25	17
11-12	8	0								

Значение десятичных дробей(визуальное) Имя: Ключ к правильным ответам

Определите часть закрашенного к целому. Напишите ответ в десятичной дроби.

1) 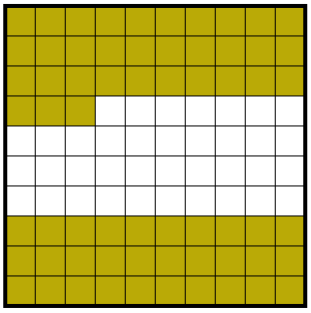

2) 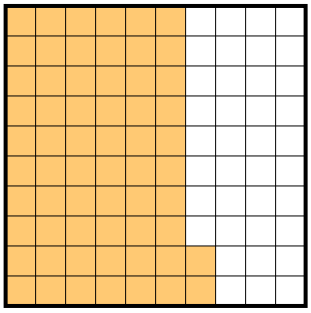

3) 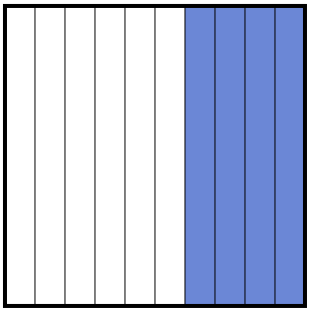

4) 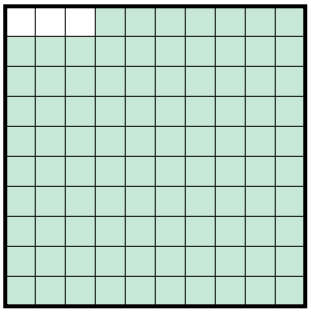

5) 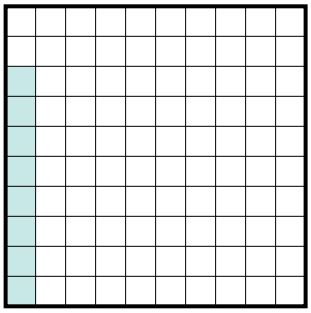

6) 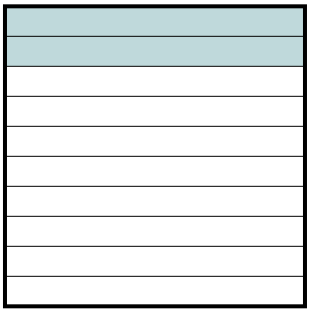

7) 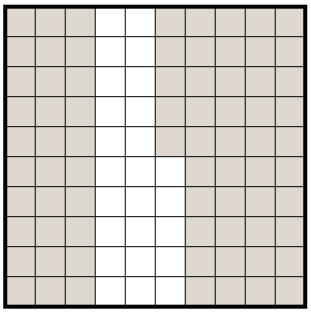

8) 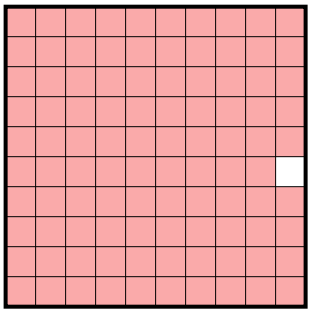

9) 

10) 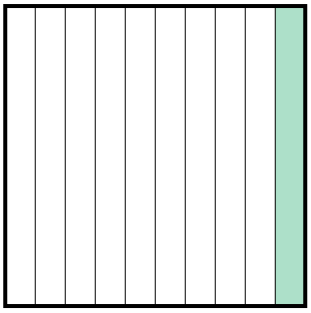

11) 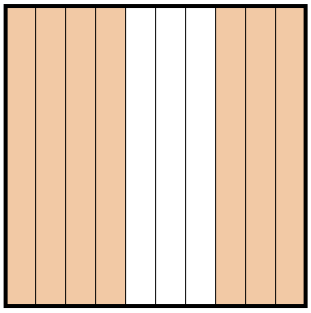

12) 

Ответы

1. 0,63
2. 0,62
3. 0,4
4. 0,97
5. 0,08
6. 0,2
7. 0,75
8. 0,99
9. 0,9
10. 0,1
11. 0,7
12. 0,5

1-10	92	83	75	67	58	50	42	33	25	17
11-12	8	0								