Расположение дробей(визуальное) Имя:

Расположите данные сектора по возрастанию, по наличию закрашенных частей.

об) A B C D

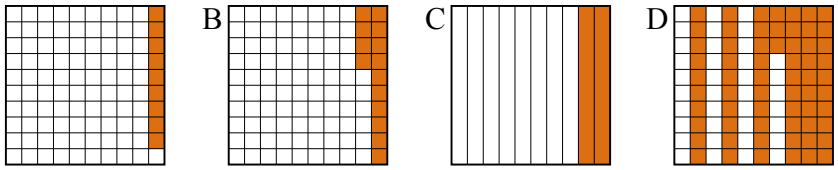

маленький 0.09 - A

0.14 - B

0.2 - C

большой 0.63 - D

1) A B C D

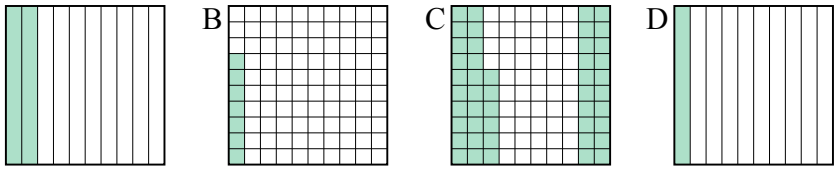

маленький _____

_____

_____

большой _____

2) A B C D

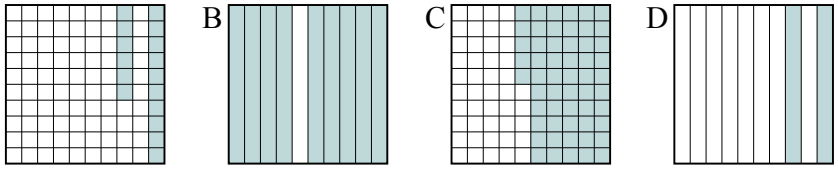

маленький _____

_____

_____

большой _____

3) A B C D

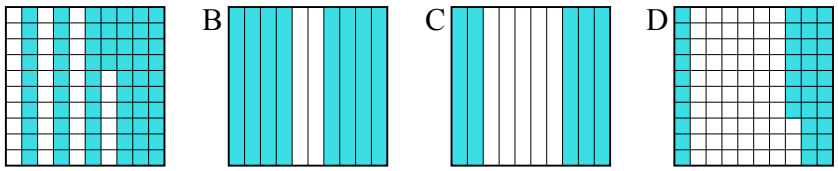

маленький _____

_____

_____

большой _____

4) A B C D

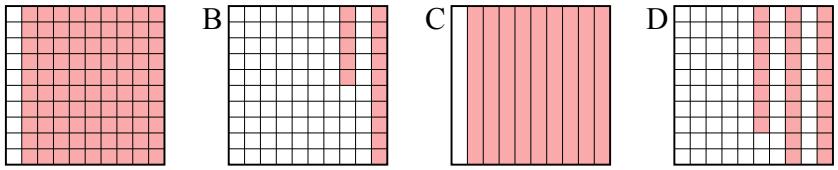

маленький _____

_____

_____

большой _____

5) A B C D

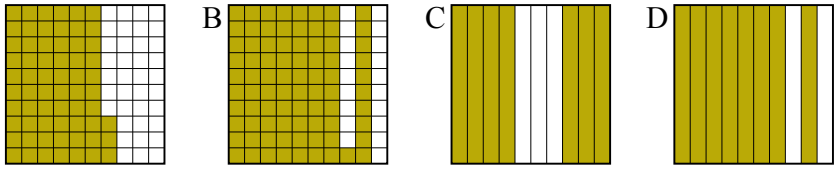

маленький _____

_____

_____

большой _____

6) A B C D

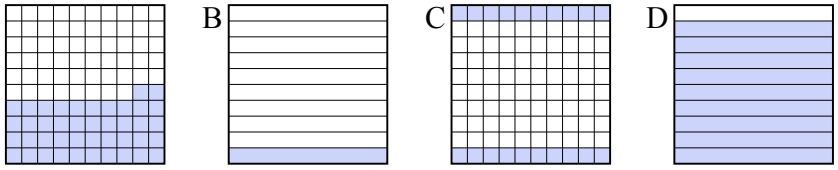

маленький _____

_____

_____

большой _____

7) A B C D

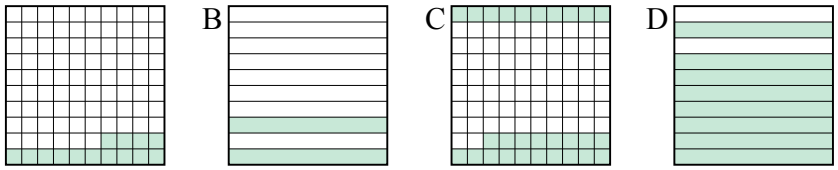

маленький _____

_____

_____

большой _____

8) A B C D

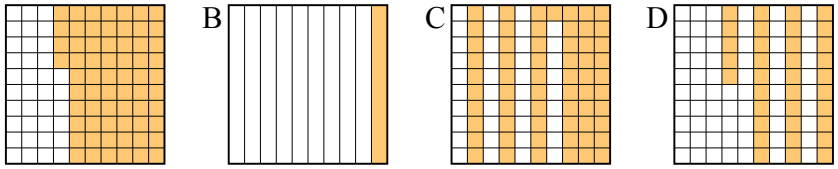

маленький _____

_____

_____

большой _____

Ответы

об. **A,B,C,D**

1. _____

2. _____

3. _____

4. _____

5. _____

6. _____

7. _____

8. _____

1-8	88	75	63	50	38	25	13	0

Расположение дробей(визуальное) Имя: Ключ к правильным ответам

Расположите данные сектора по возрастанию, по наличию закрашенных частей.

об)

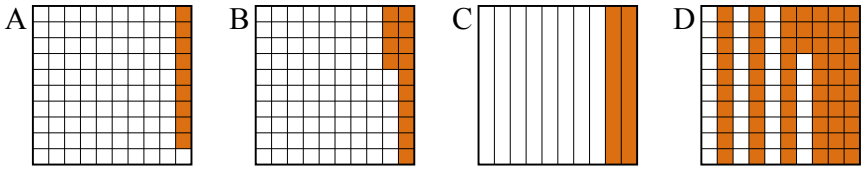

маленький 0.09 - A
0.14 - B
0.2 - C
большой 0.63 - D

1)

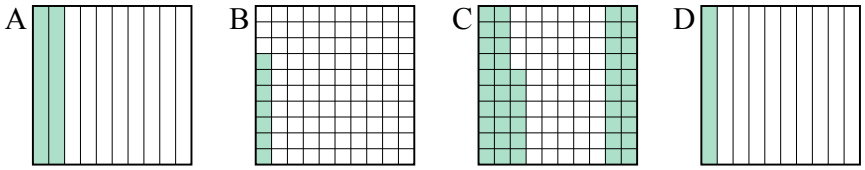

маленький 0.07 - B
0.1 - D
0.2 - A
большой 0.46 - C

2)

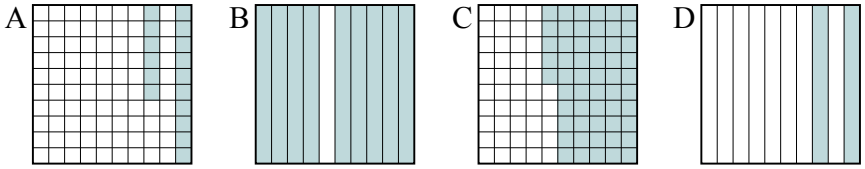

маленький 0.16 - A
0.2 - D
0.55 - C
большой 0.9 - B

3)

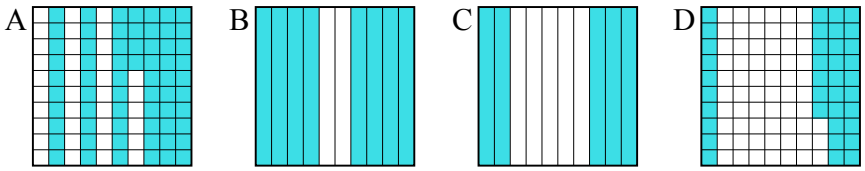

маленький 0.37 - D
0.5 - C
0.64 - A
большой 0.8 - B

4)

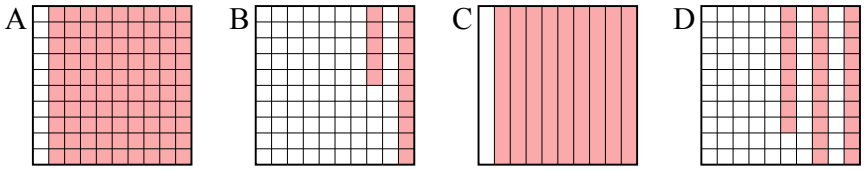

маленький 0.15 - B
0.28 - D
0.9 - A
большой 0.9 - A

5)

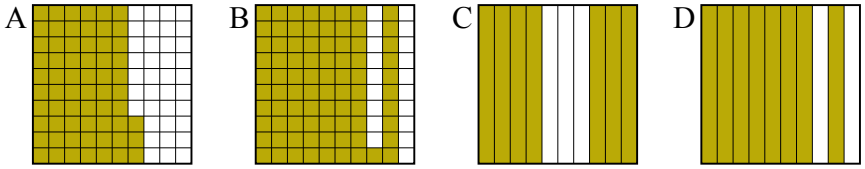

маленький 0.63 - A
0.7 - C
0.8 - D
большой 0.81 - B

6)

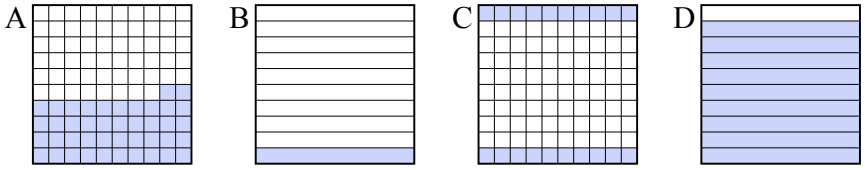

маленький 0.1 - B
0.2 - C
0.42 - A
большой 0.9 - D

7)

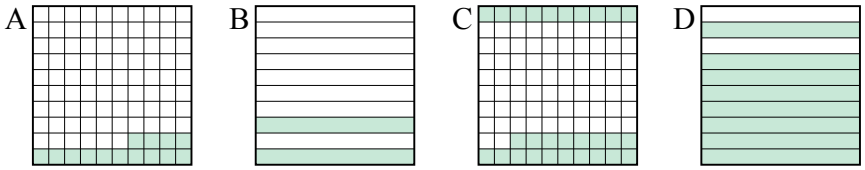

маленький 0.14 - A
0.2 - B
0.28 - C
большой 0.8 - D

8)

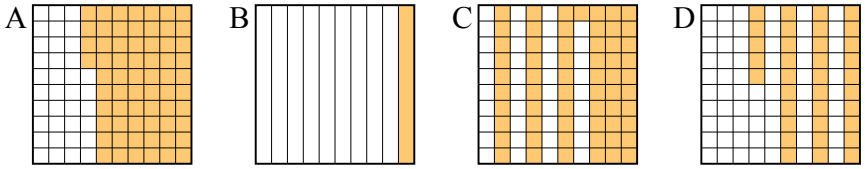

маленький 0.1 - B
0.35 - D
0.61 - C
большой 0.64 - A

Ответы

об.	A,B,C,D
1.	B,D,A,C
2.	A,D,C,B
3.	D,C,A,B
4.	B,D,A,A
5.	A,C,D,B
6.	B,C,A,D
7.	A,B,C,D
8.	B,D,C,A

1-8	88	75	63	50	38	25	13	0