Умножение десятичных дробей по решетке Имя:

Используйте визуальную модель, чтобы решить задачу.

1) $4 \times 0{,}9 =$

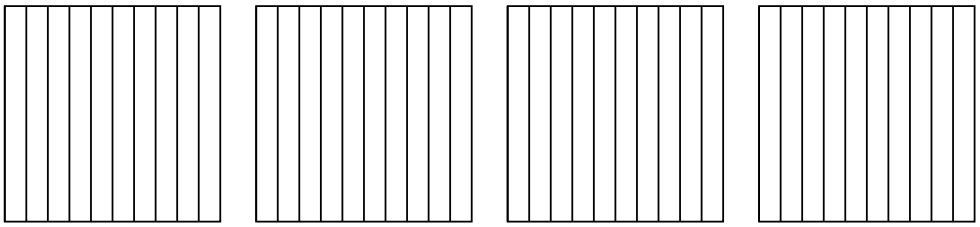

2) $4 \times 0{,}39 =$

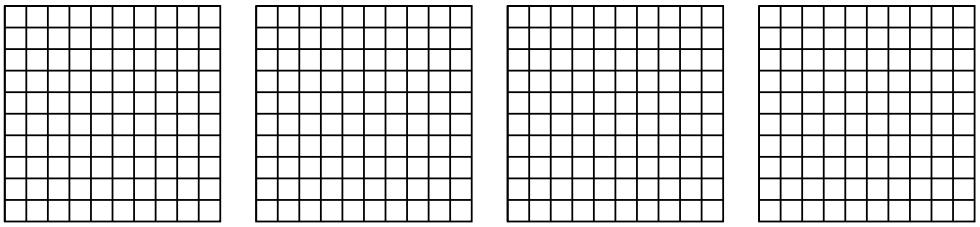

3) $3 \times 0{,}54 =$



4) $2 \times 0{,}79 =$

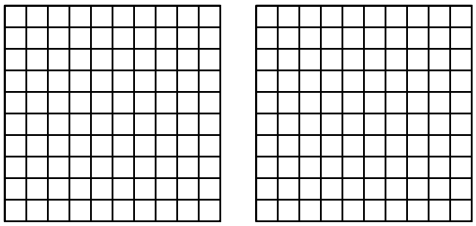

5) $3 \times 0{,}2 =$

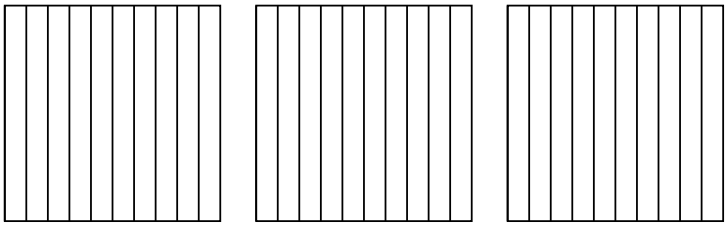

6) $2 \times 0{,}23 =$

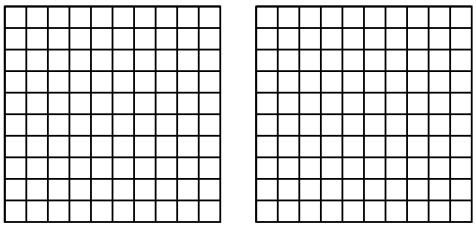

Ответы

1. _____
2. _____
3. _____
4. _____
5. _____
6. _____

1-6	83	67	50	33	17	0

Умножение десятичных дробей по решетке Имя: Ключ к правильным ответам

Используйте визуальную модель, чтобы решить задачу.

1) $4 \times 0{,}9 =$

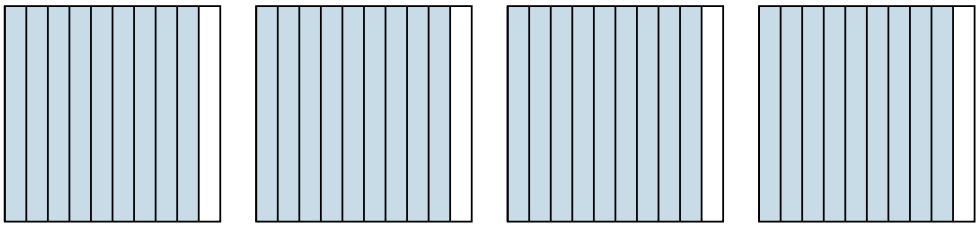

2) $4 \times 0{,}39 =$

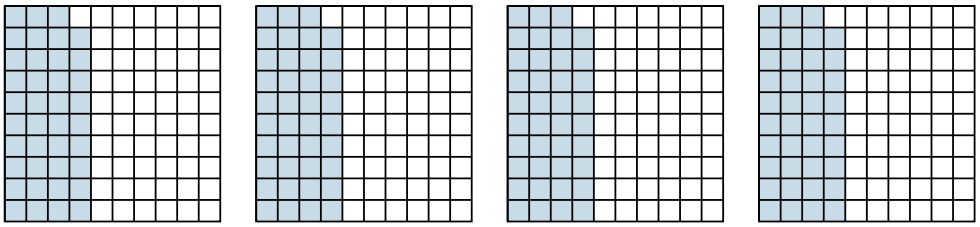

3) $3 \times 0{,}54 =$

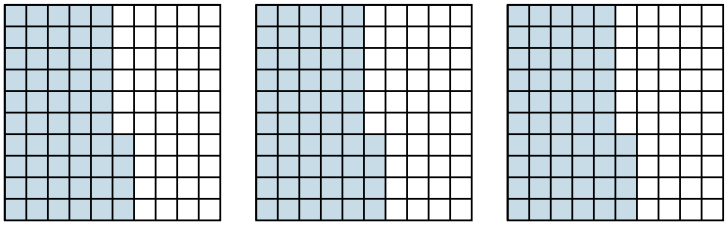

4) $2 \times 0{,}79 =$

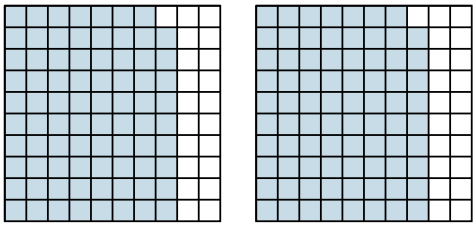

5) $3 \times 0{,}2 =$

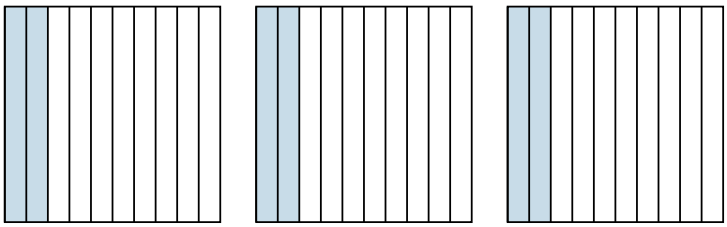

6) $2 \times 0{,}23 =$

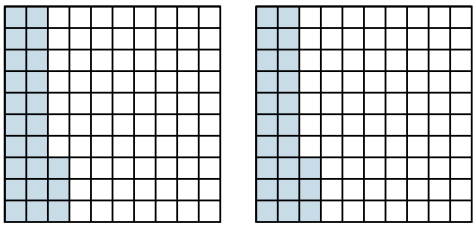

Ответы

1. $^{36}/_{10} = 3{,}6$
2. $^{156}/_{100} = 1{,}56$
3. $^{162}/_{100} = 1{,}62$
4. $^{158}/_{100} = 1{,}58$
5. $^{6}/_{10} = 0{,}6$
6. $^{46}/_{100} = 0{,}46$

1-6	83	67	50	33	17	0