Умножение десятичных дробей по решетке Имя:

Используйте визуальную модель, чтобы решить задачу.

1) $4 \times 0{,}5 =$

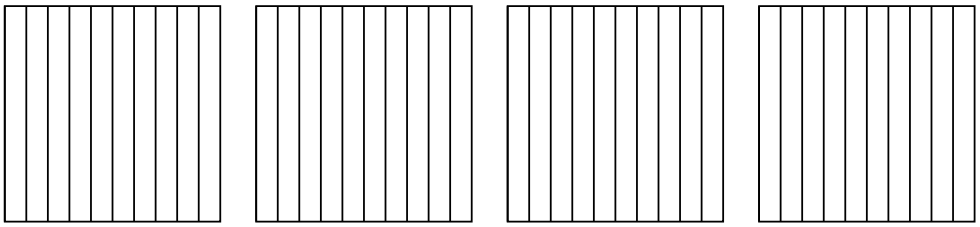

2) $4 \times 0{,}92 =$

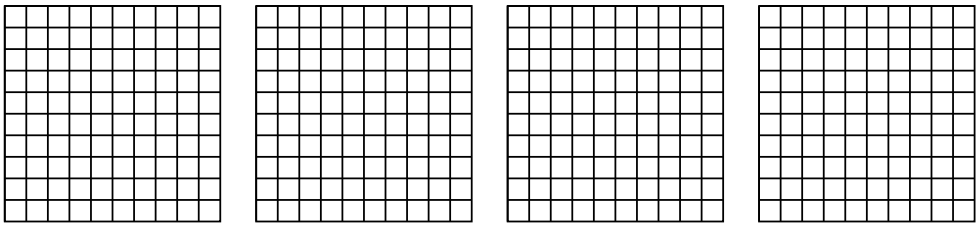

3) $3 \times 0{,}36 =$



4) $2 \times 0{,}2 =$

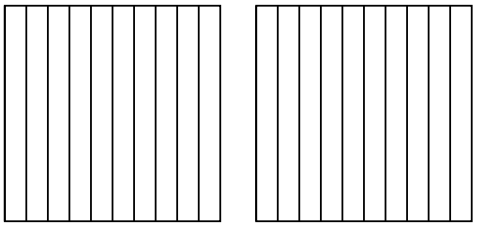

5) $3 \times 0{,}6 =$

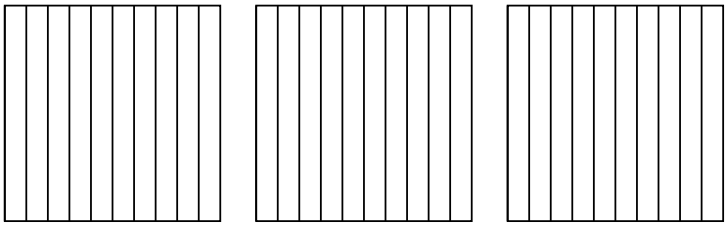

6) $2 \times 0{,}44 =$

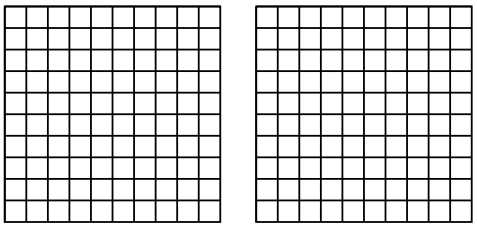

Ответы

1. _____
2. _____
3. _____
4. _____
5. _____
6. _____

1-6	83	67	50	33	17	0

Умножение десятичных дробей по решетке Имя: Ключ к правильным ответам

Используйте визуальную модель, чтобы решить задачу.

1) 4 × 0,5 =

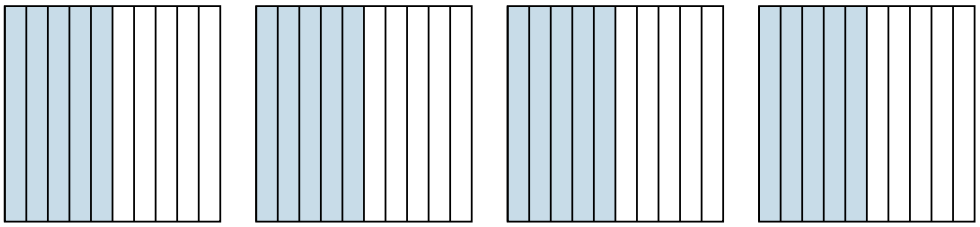

2) 4 × 0,92 =

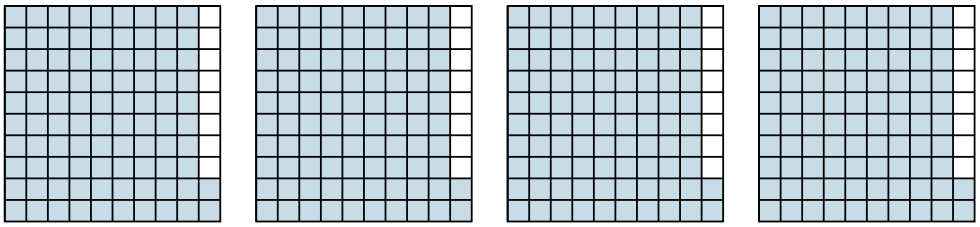

3) 3 × 0,36 =

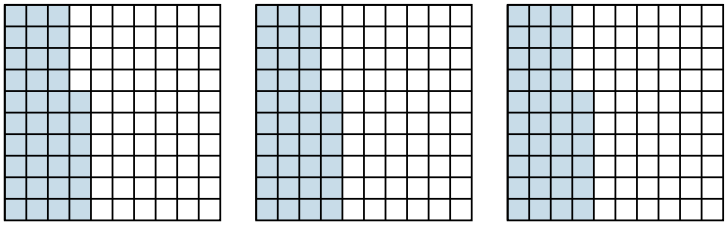

4) 2 × 0,2 =

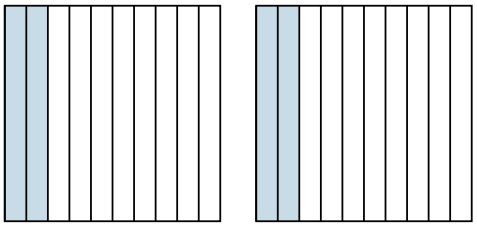

5) 3 × 0,6 =

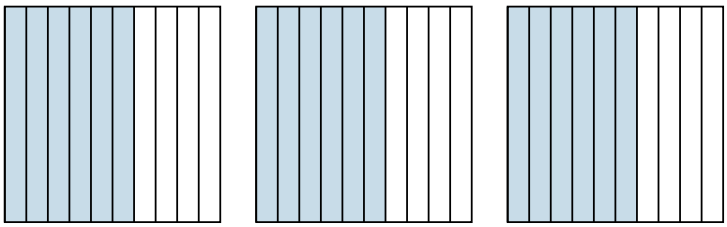

6) 2 × 0,44 =

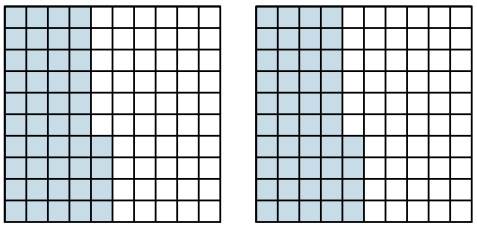

Ответы

1. $^{20}/_{10} = 2$
2. $^{368}/_{100} = 3{,}68$
3. $^{108}/_{100} = 1{,}08$
4. $^{4}/_{10} = 0{,}4$
5. $^{18}/_{10} = 1{,}8$
6. $^{88}/_{100} = 0{,}88$

1-6	83	67	50	33	17	0