Определение значения дроби по блокам Имя:

Используйте блок слева для нахождения значения наборов блоков справа.

1) 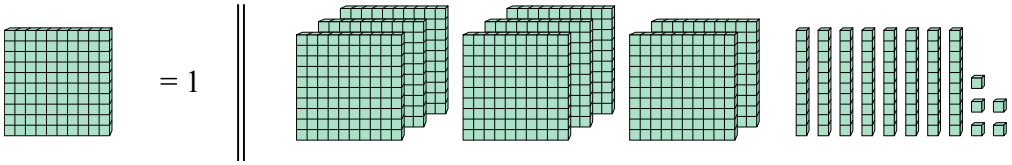

2) 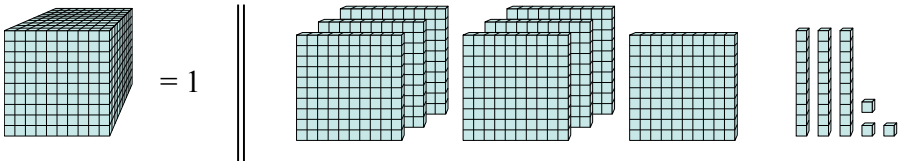

3) 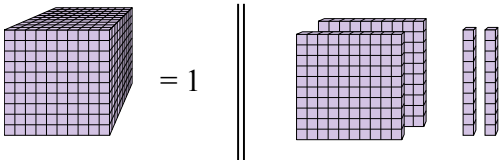

4) 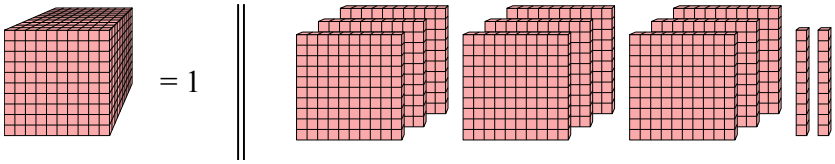

5) 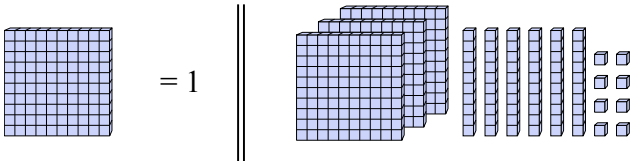

6) 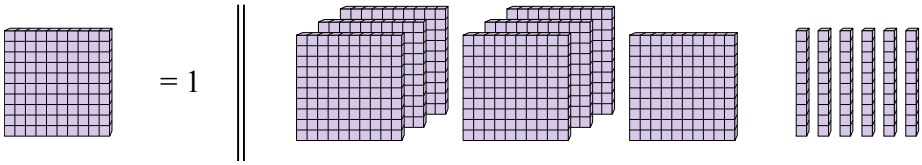

7) 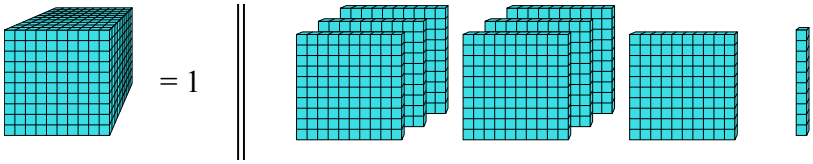

8) 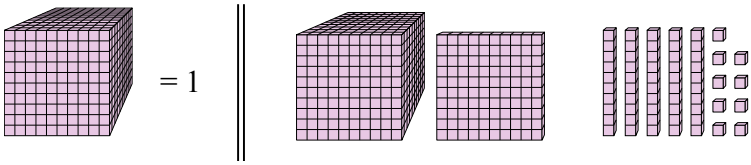

9) 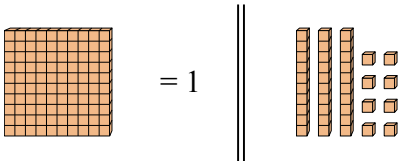

10) 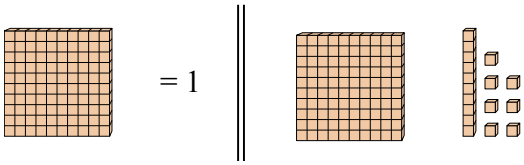

Ответы

1. _____
2. _____
3. _____
4. _____
5. _____
6. _____
7. _____
8. _____
9. _____
10. _____

1-10	90	80	70	60	50	40	30	20	10	0

Определение значения дроби по блокам Имя: **Ключ к правильным ответам**

Используйте блок слева для нахождения значения наборов блоков справа.

1)

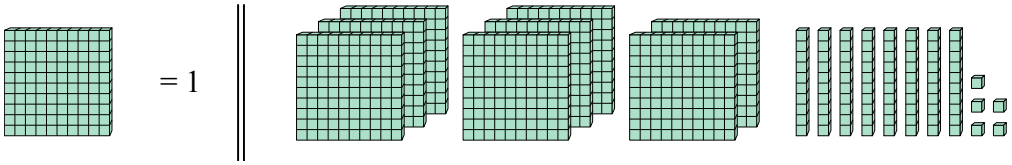

2)

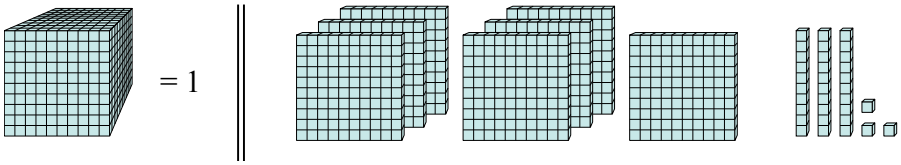

3)

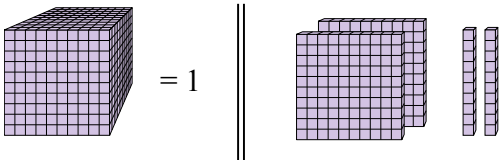

4)

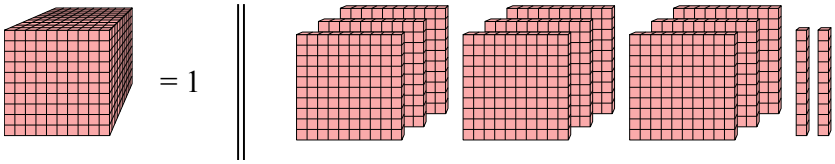

5)

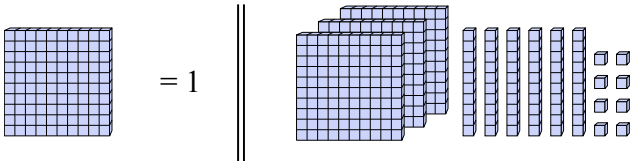

6)

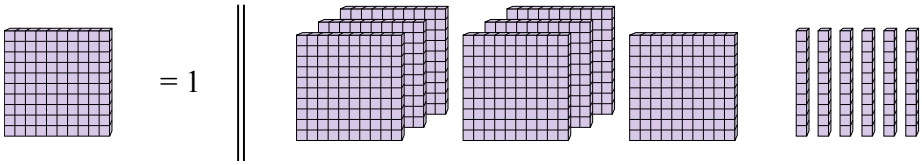

7)

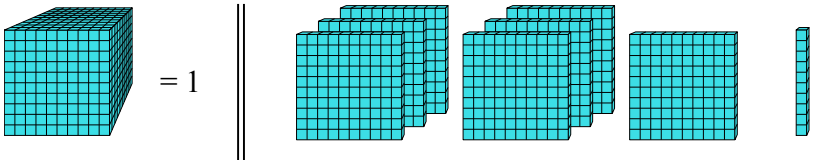

8)

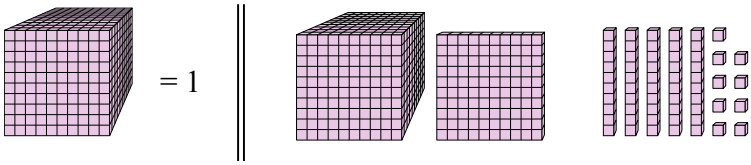

9)

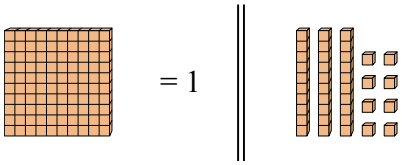

10)

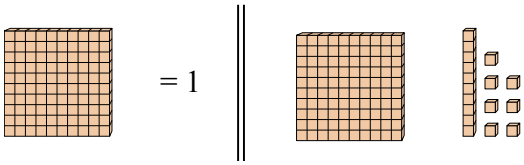

Ответы

1. **8,85**
2. **0,733**
3. **0,22**
4. **0,92**
5. **3,68**
6. **7,6**
7. **0,71**
8. **1,159**
9. **0,38**
10. **1,17**

1-10	90	80	70	60	50	40	30	20	10	0