Определение значения дроби по блокам Имя:

Используйте блок слева для нахождения значения наборов блоков справа.

1) 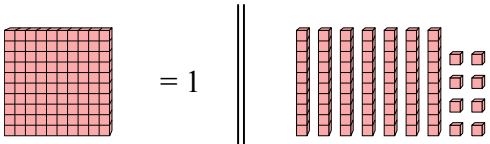

2) 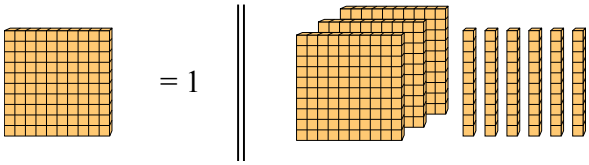

3) 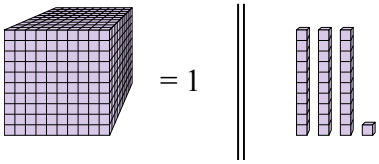

4) 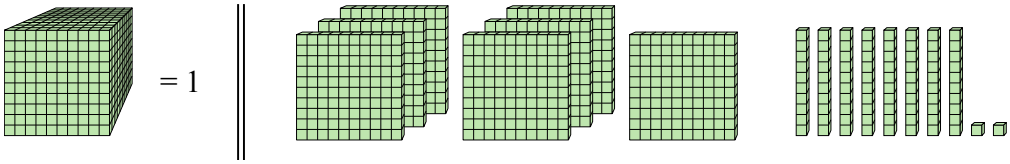

5) 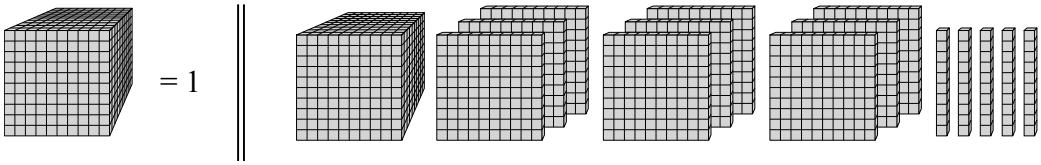

6) 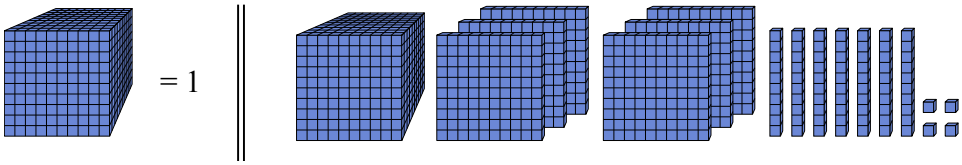

7) 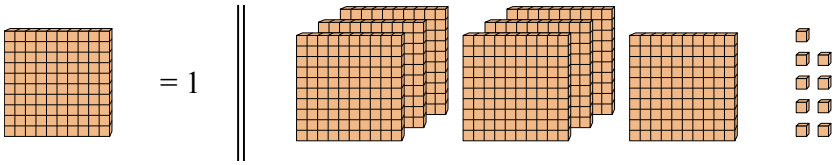

8) 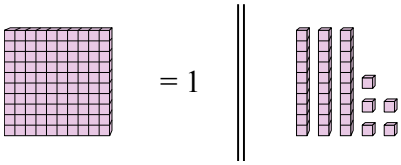

9) 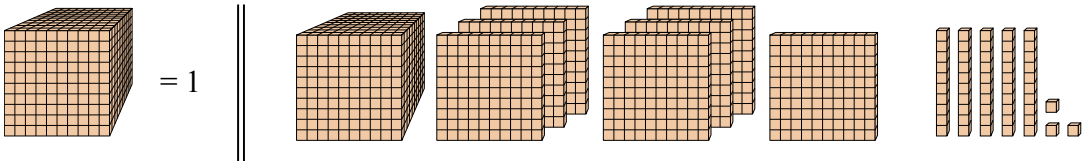

10) 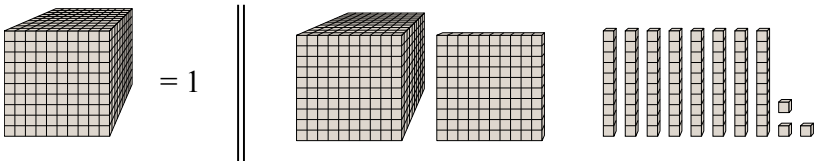

Ответы

1. _____
2. _____
3. _____
4. _____
5. _____
6. _____
7. _____
8. _____
9. _____
10. _____

1-10	90	80	70	60	50	40	30	20	10	0

Определение значения дроби по блокам Имя: Ключ к правильным ответам

Используйте блок слева для нахождения значения наборов блоков справа.

1) 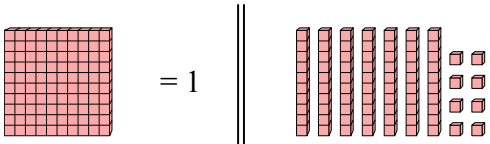

2) 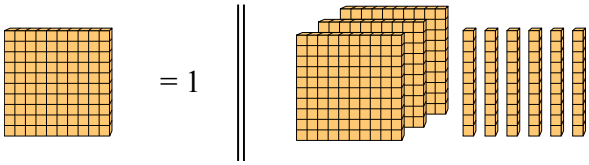

3) 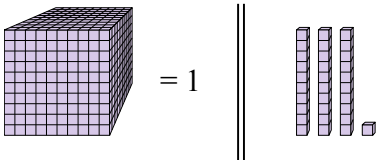

4) 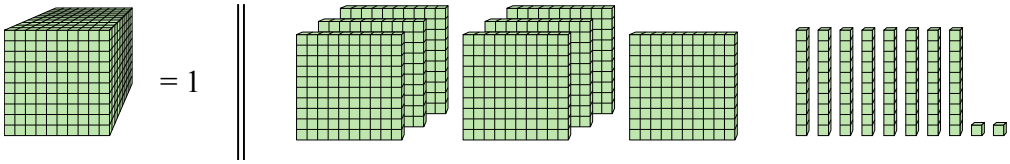

5) 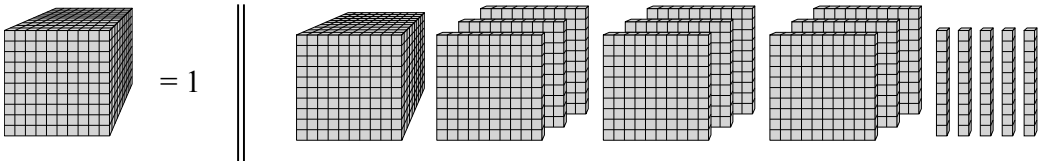

6) 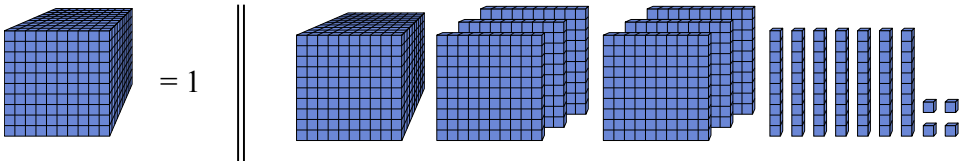

7) 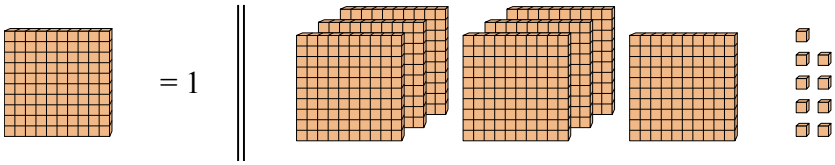

8) 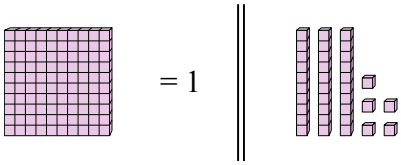

9) 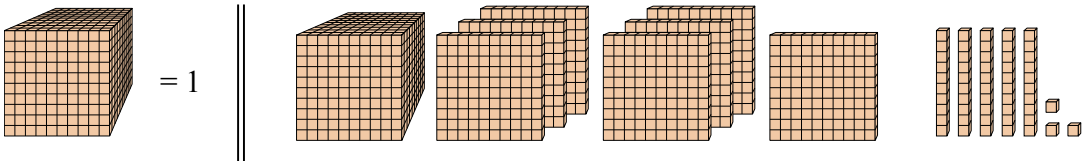

10) 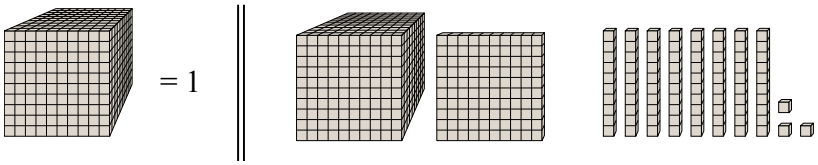

Ответы

1. 0,78
2. 3,6
3. 0,031
4. 0,782
5. 1,95
6. 1,674
7. 7,09
8. 0,35
9. 1,753
10. 1,183

1-10	90	80	70	60	50	40	30	20	10	0