Подсчет фигур

Имя:

Подсчитайте количество данных фигур

1) 

2) 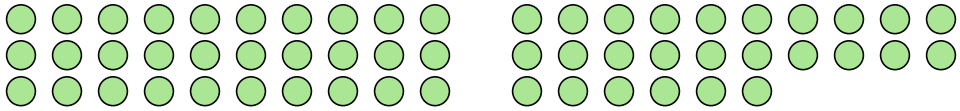

3) 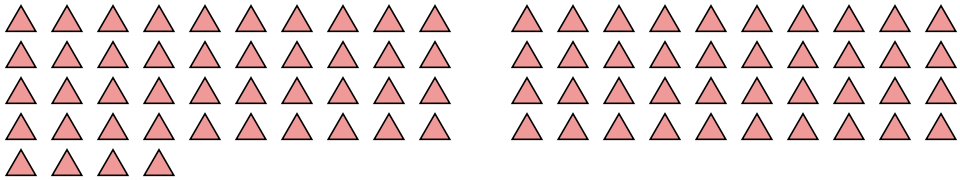

4)

5) 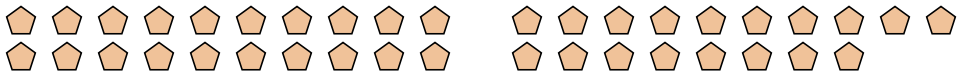

Ответы

1. _____

2. _____

3. _____

4. _____

5. _____

1-5	80	60	40	20	0

Подсчет фигур

Имя: Ключ к правильным ответам

Подсчитайте количество данных фигур

1) 

2) 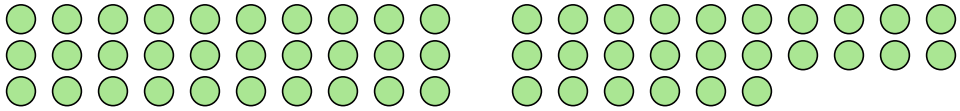

3) 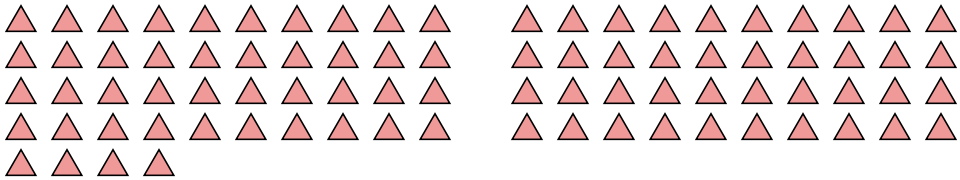

4)

5) 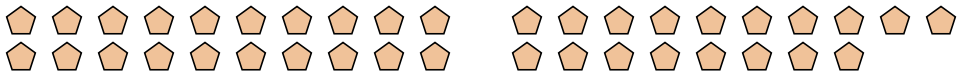

Ответы

1. 73
2. 56
3. 84
4. 103
5. 38

1-5	80	60	40	20	0

Подсчет фигур

Имя:

Подсчитайте количество данных фигур

1)

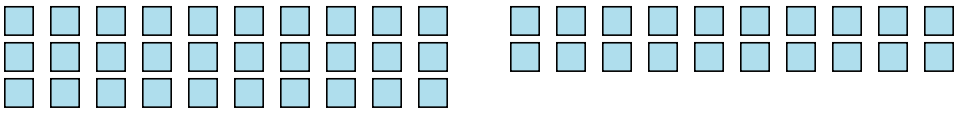

2)

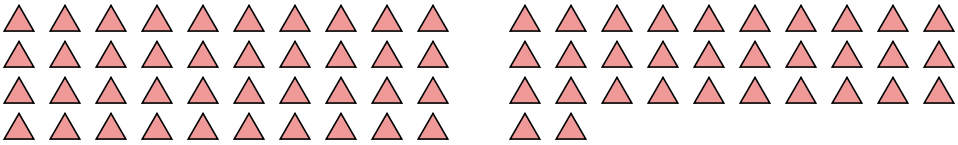

3)

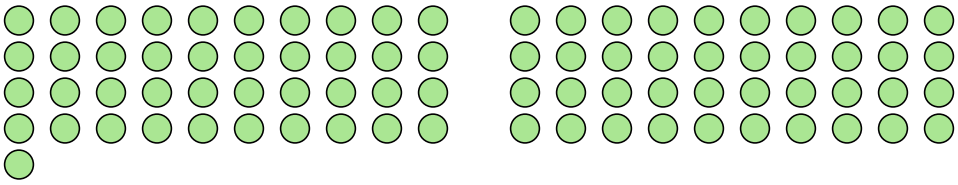

4)

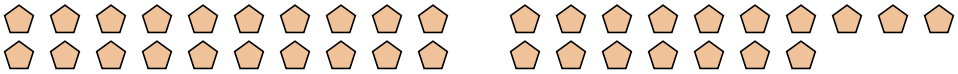

5)

Ответы

1. _____

2. _____

3. _____

4. _____

5. _____

1-5	80	60	40	20	0

Подсчет фигур

Имя: Ключ к правильным ответам

Подсчитайте количество данных фигур

1) 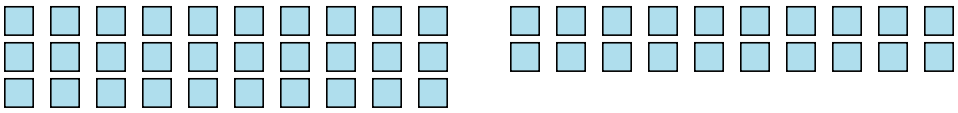

2) 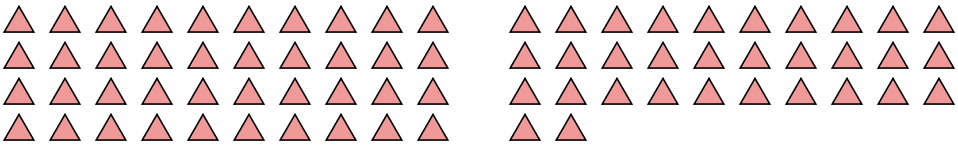

3) 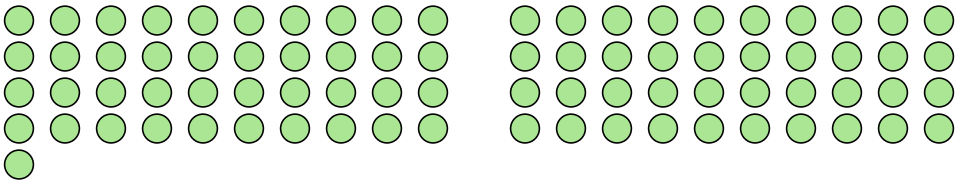

4) 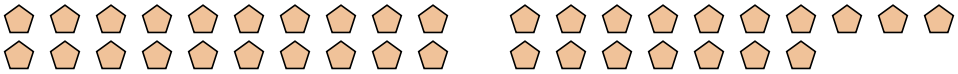

5)

Ответы

1. 50
2. 72
3. 81
4. 37
5. 17

1-5	80	60	40	20	0

Подсчет фигур

Имя:

Подсчитайте количество данных фигур

1) 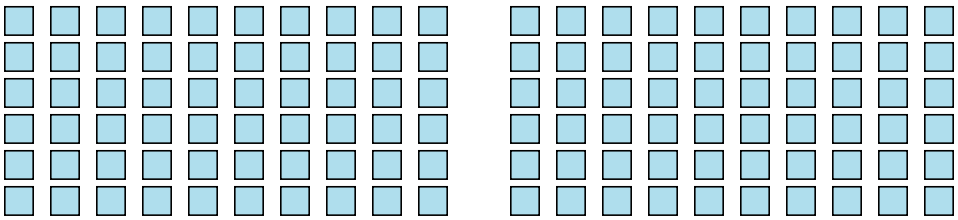

2)

3) 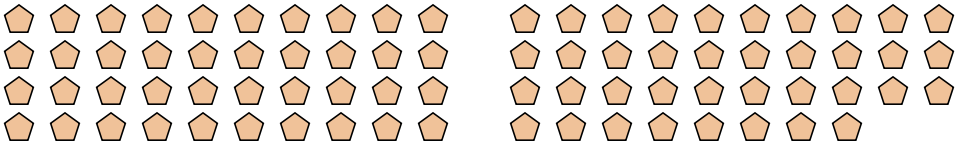

4) 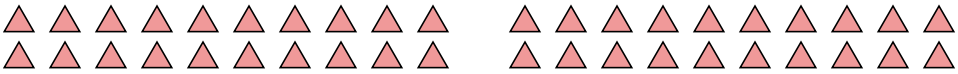

5) 

Ответы

1. _____

2. _____

3. _____

4. _____

5. _____

1-5	80	60	40	20	0

Подсчет фигур

Имя: **Ключ к правильным ответам**

Подсчитайте количество данных фигур

1) 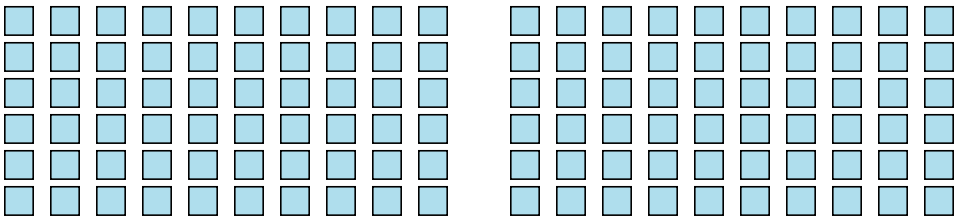

2)

3) 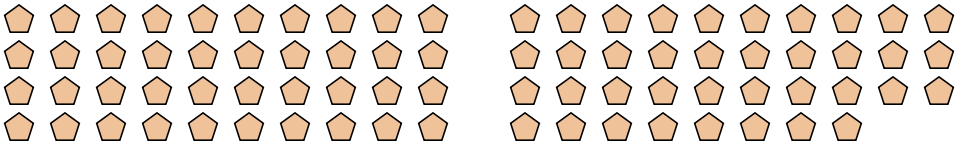

4) 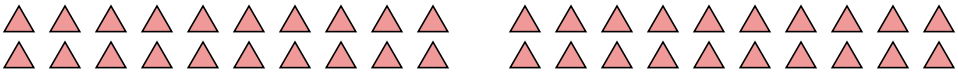

5) 

Ответы

1. **120**
2. **59**
3. **78**
4. **40**
5. **91**

1-5	80	60	40	20	0

Подсчет фигур

Имя:

Подсчитайте количество данных фигур

1)

2)

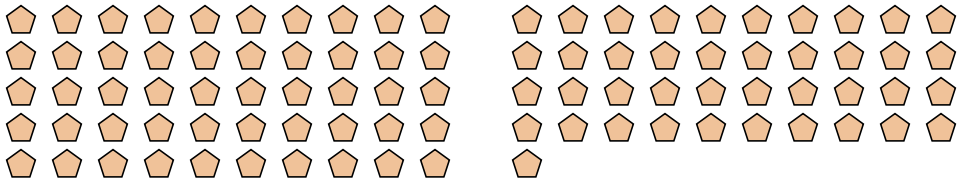

3)

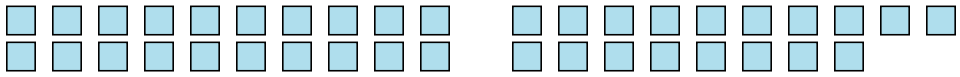

4)

5)

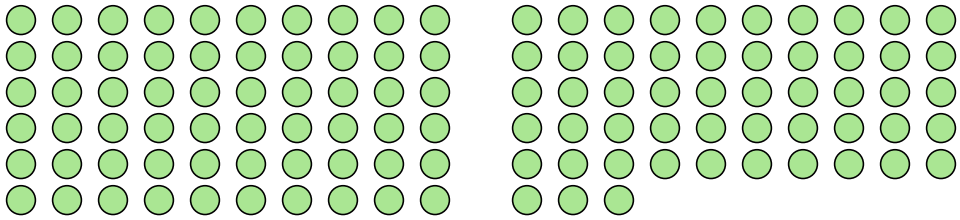

Ответы

1. _____

2. _____

3. _____

4. _____

5. _____

1-5	80	60	40	20	0

Подсчет фигур

Имя: Ключ к правильным ответам

Подсчитайте количество данных фигур

1)

2) 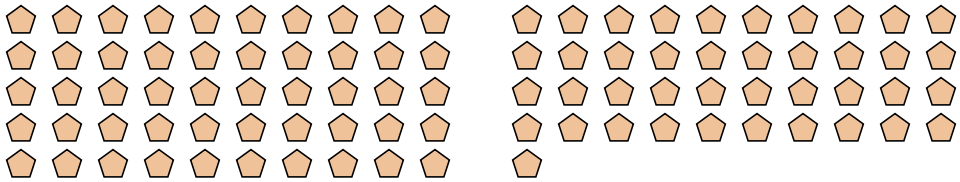

3) 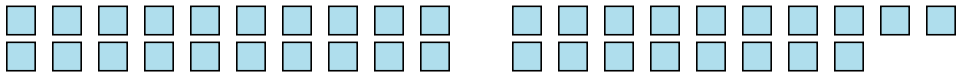

4)

5) 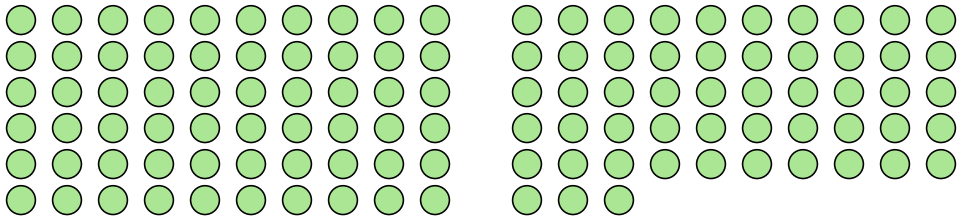

Ответы

1. 51
2. 91
3. 38
4. 8
5. 113

1-5	80	60	40	20	0

Подсчет фигур

Имя:

Подсчитайте количество данных фигур

1)

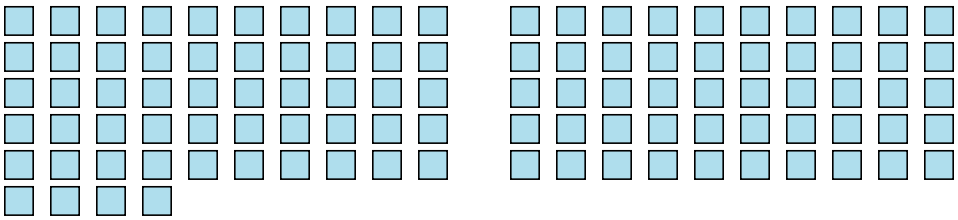

2)

3)

4)

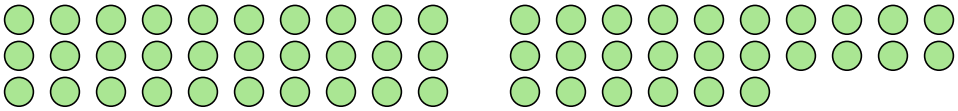

5)

Ответы

1. _____
2. _____
3. _____
4. _____
5. _____

1-5	80	60	40	20	0

Подсчет фигур

Имя: Ключ к правильным ответам

Подсчитайте количество данных фигур

1) 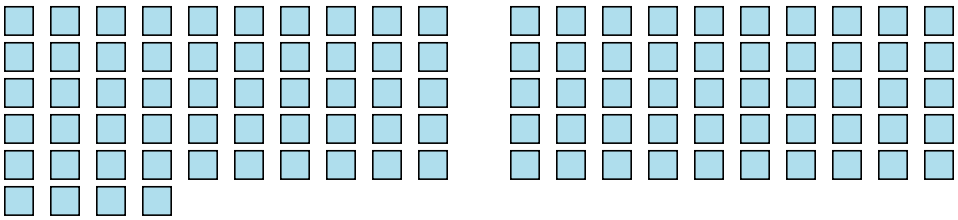

2)

3)

4) 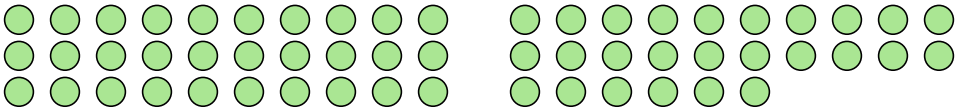

5)

Ответы

1. 104
2. 69
3. 17
4. 56
5. 25

1-5	80	60	40	20	0

Подсчет фигур

Имя:

Подсчитайте количество данных фигур

1)

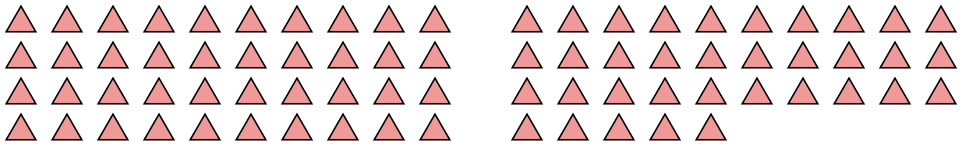

2)

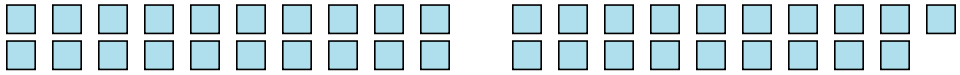

3)

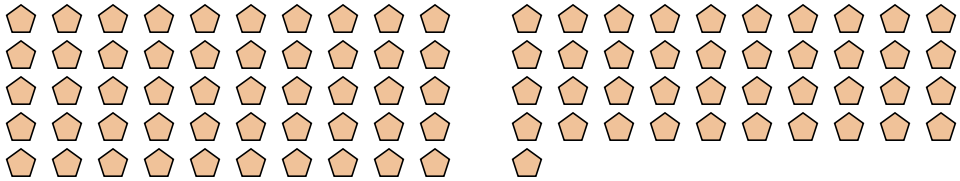

4)

5)

Ответы

1. _____

2. _____

3. _____

4. _____

5. _____

1-5	80	60	40	20	0

Подсчет фигур

Имя: Ключ к правильным ответам

Подсчитайте количество данных фигур

1) 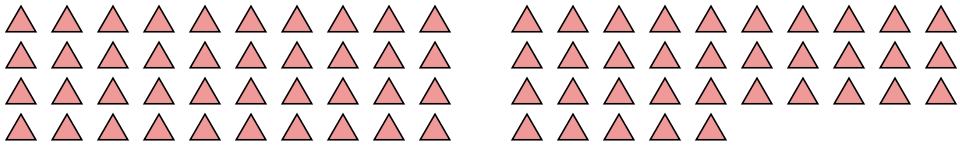

2) 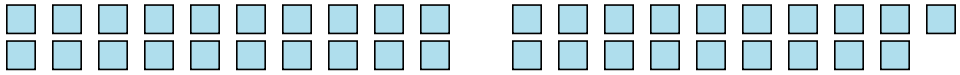

3) 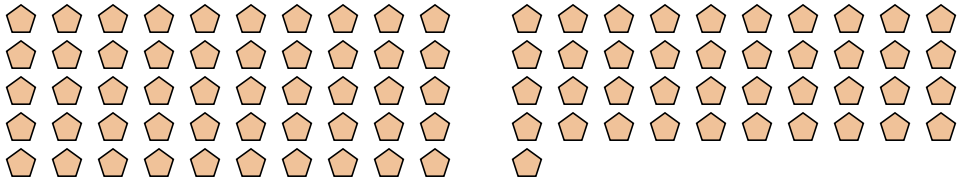

4)

5)

Ответы

1. 75
2. 39
3. 91
4. 15
5. 106

1-5	80	60	40	20	0

Подсчет фигур

Имя:

Подсчитайте количество данных фигур

1) 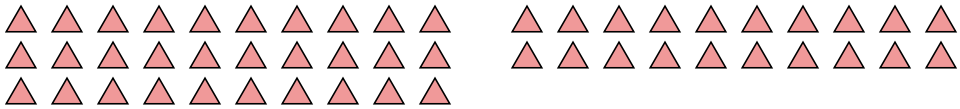

2) 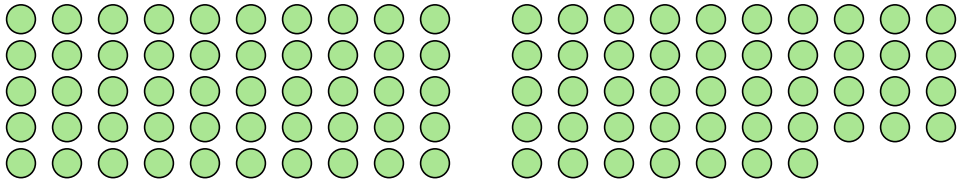

3)

4) 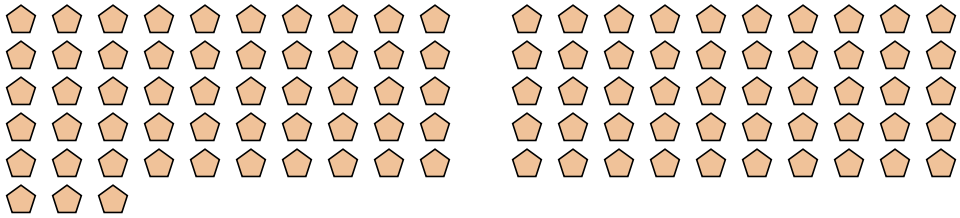

5)

Ответы

1. _____

2. _____

3. _____

4. _____

5. _____

1-5	80	60	40	20	0

Подсчет фигур

Имя: Ключ к правильным ответам

Подсчитайте количество данных фигур

1) 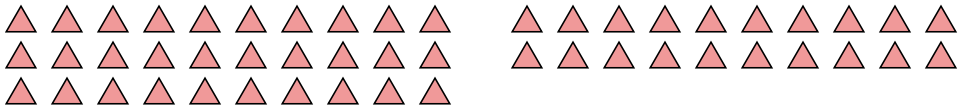

2) 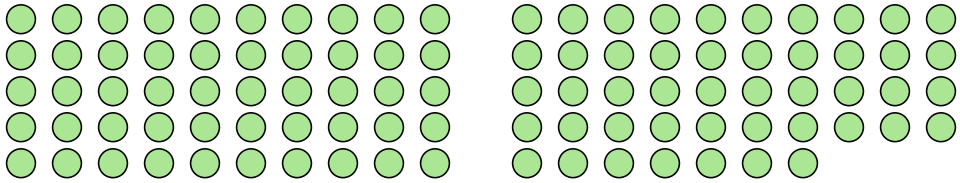

3)

4) 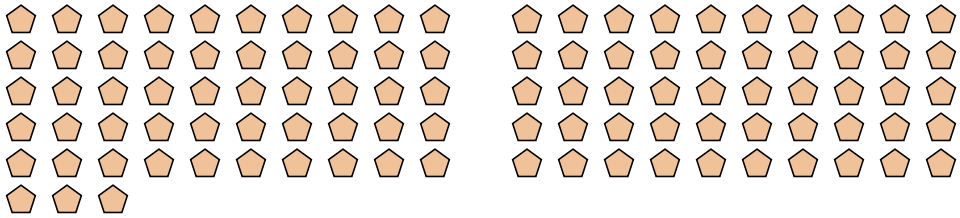

5)

Ответы

1. 50
2. 97
3. 27
4. 103
5. 64

1-5	80	60	40	20	0

Подсчет фигур

Имя:

Подсчитайте количество данных фигур

1) 

2) 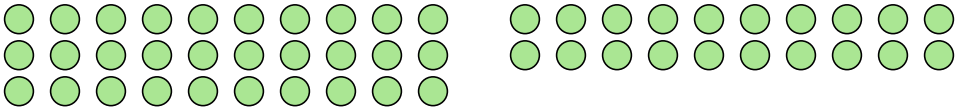

3) 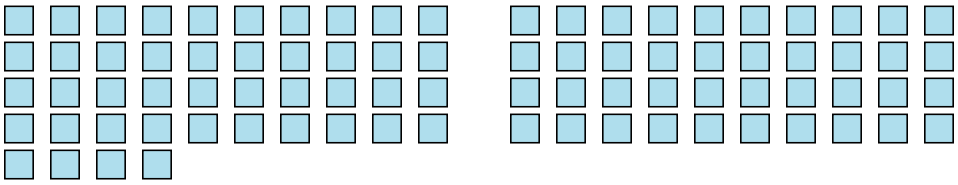

4) 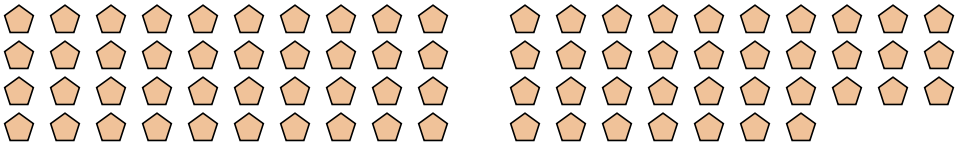

5)

Ответы

1. _____

2. _____

3. _____

4. _____

5. _____

1-5	80	60	40	20	0

Подсчет фигур

Имя: Ключ к правильным ответам

Подсчитайте количество данных фигур

1) 

2) 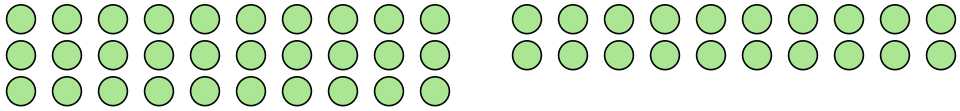

3) 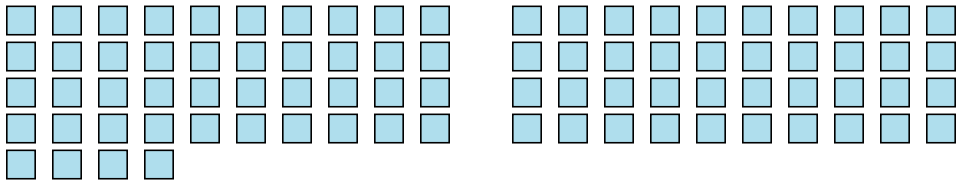

4) 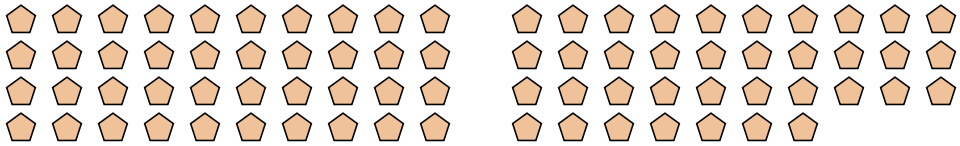

5)

Ответы

1. 108
2. 50
3. 84
4. 77
5. 31

1-5	80	60	40	20	0

Подсчет фигур

Имя:

Подсчитайте количество данных фигур

1)

2)

3) 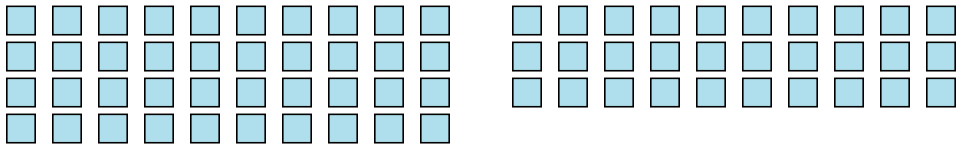

4)

5) 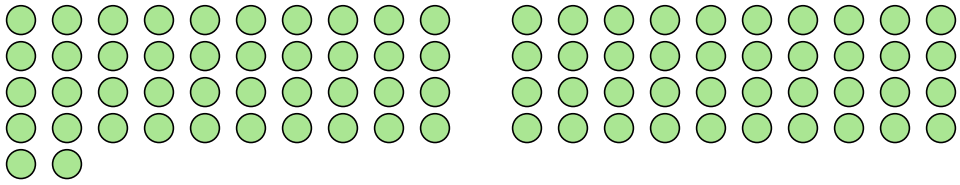

Ответы

1. _____

2. _____

3. _____

4. _____

5. _____

1-5	80	60	40	20	0

Подсчет фигур

Имя: **Ключ к правильным ответам**

Подсчитайте количество данных фигур

1)

2)

3)

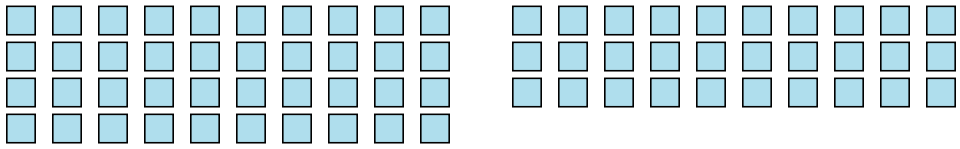

4)

5)

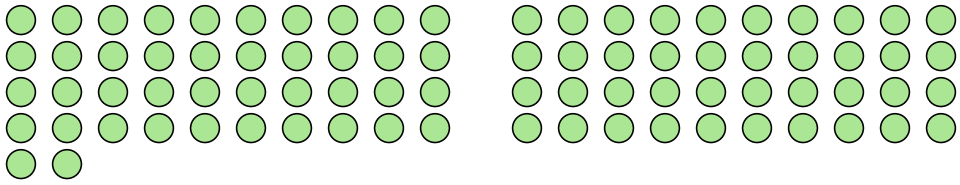

Ответы

1. **52**
2. **7**
3. **70**
4. **22**
5. **82**

1-5	80	60	40	20	0

Подсчет фигур

Имя:

Подсчитайте количество данных фигур

1) 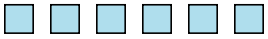

2)

3)

4) 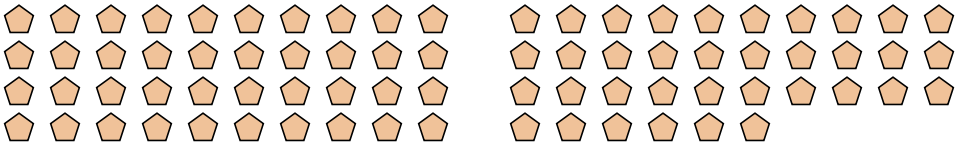

5) 

Ответы

1. _____

2. _____

3. _____

4. _____

5. _____

1-5	80	60	40	20	0

Подсчитайте количество данных фигур

1) 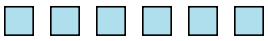

2)

3)

4) 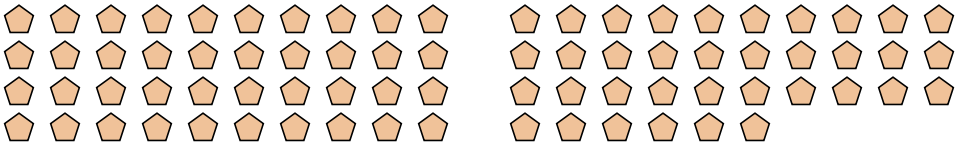

5) 

Ответы

1. 6
2. 51
3. 31
4. 76
5. 103

1-5	80	60	40	20	0