Подсчет десятков Имя:

Найдите количество десятков. Затем определите общее число маленьких блоков.

1) 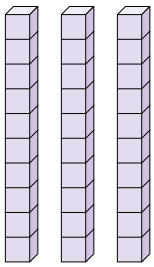

2) 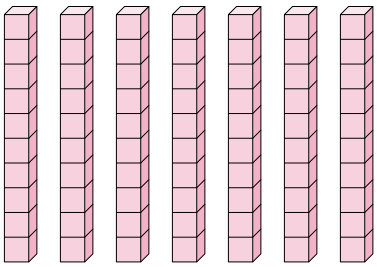

3) 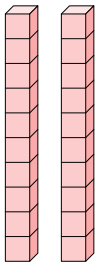

4) 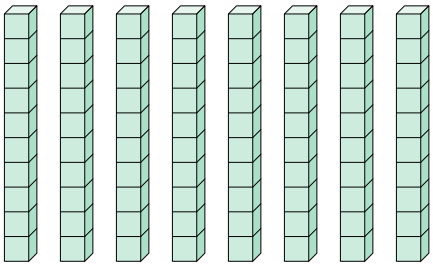

5) 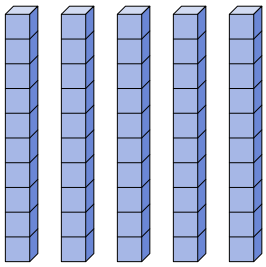

6) 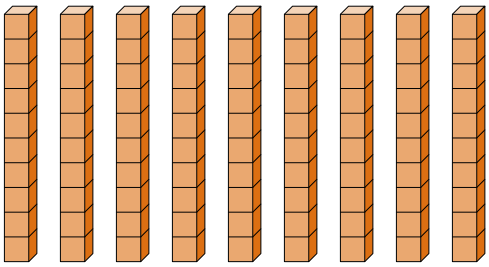

7) 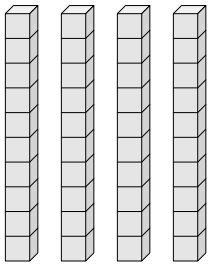

8) 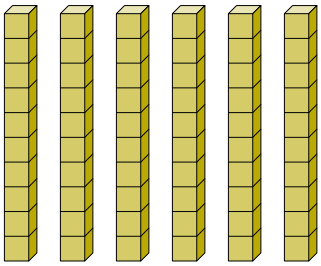

Ответы

1. _____ _____
2. _____ _____
3. _____ _____
4. _____ _____
5. _____ _____
6. _____ _____
7. _____ _____
8. _____ _____

1-8	88	75	63	50	38	25	13	0

Подсчет десятков

Имя: **Ключ к правильным ответам**

Найдите количество десятков. Затем определите общее число маленьких блоков.

1)

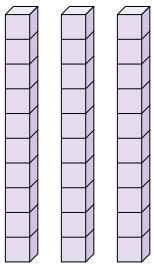

2)

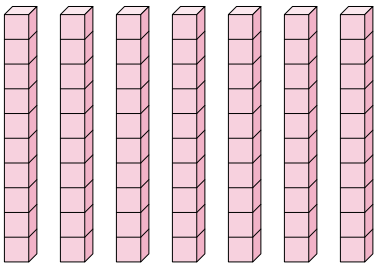

3)

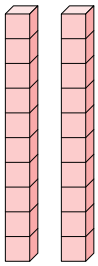

4)

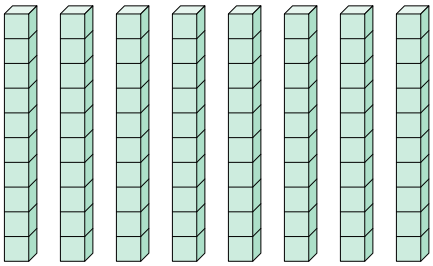

5)

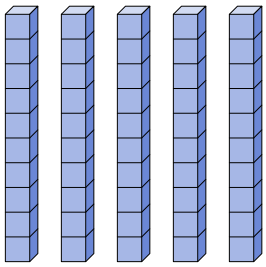

6)

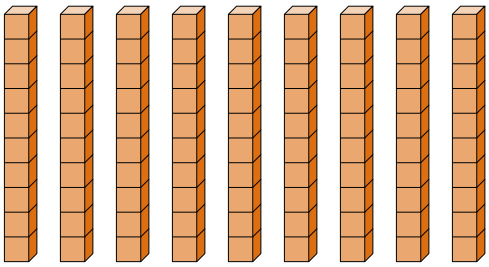

7)

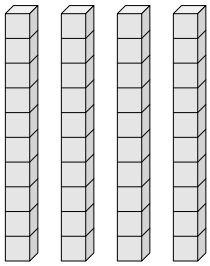

8)

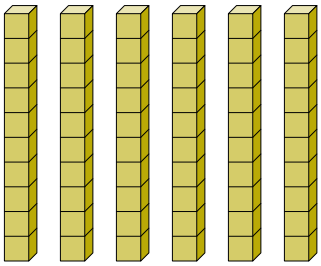

Ответы

1.	3	30
2.	7	70
3.	2	20
4.	8	80
5.	5	50
6.	9	90
7.	4	40
8.	6	60

1-8	88	75	63	50	38	25	13	0