Подсчет десятков Имя:

Найдите количество десятков. Затем определите общее число маленьких блоков.

1) 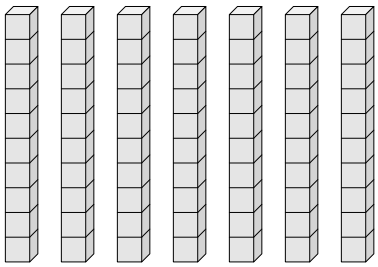

2) 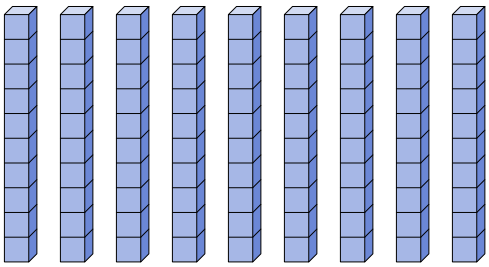

3) 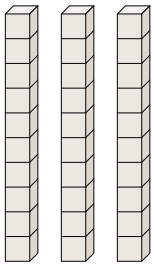

4) 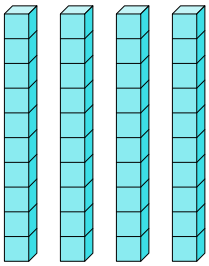

5) 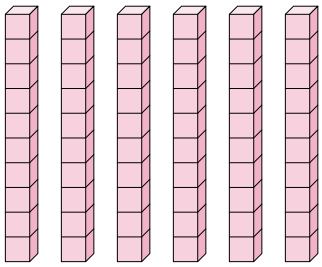

6) 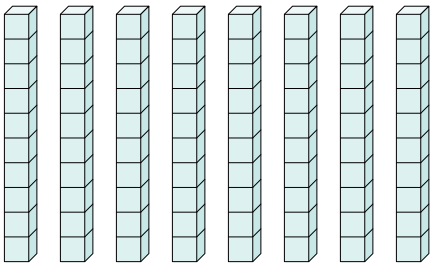

7) 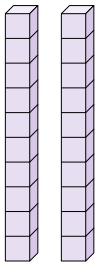

8) 

Ответы

1. _____ _____
2. _____ _____
3. _____ _____
4. _____ _____
5. _____ _____
6. _____ _____
7. _____ _____
8. _____ _____

1-8	88	75	63	50	38	25	13	0

Подсчет десятков

Имя: Ключ к правильным ответам

Найдите количество десятков. Затем определите общее число маленьких блоков.

1) 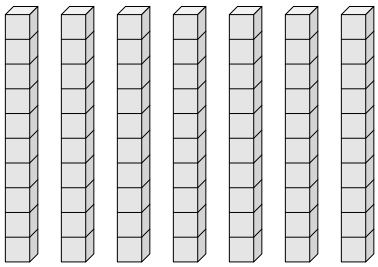

2) 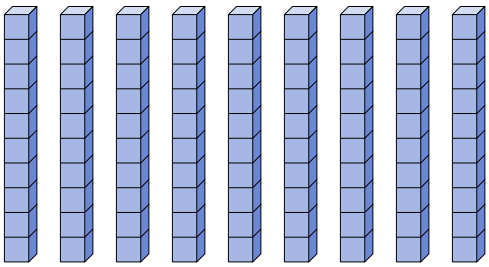

3) 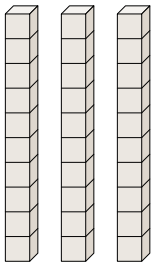

4) 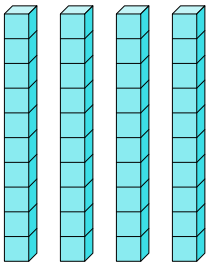

5) 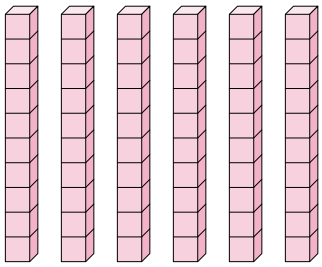

6) 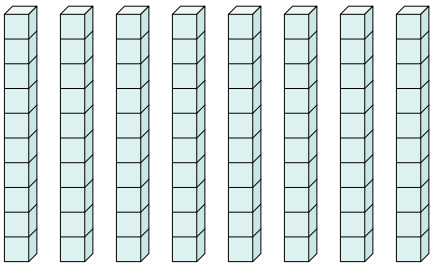

7) 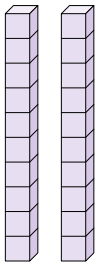

8) 

Ответы

1.	7	70
2.	9	90
3.	3	30
4.	4	40
5.	6	60
6.	8	80
7.	2	20
8.	5	50

1-8	88	75	63	50	38	25	13	0