Определение периметра

Имя:

Определите периметр закрашенной фигуры. Каждый блок равен 1 единице (u).

1)

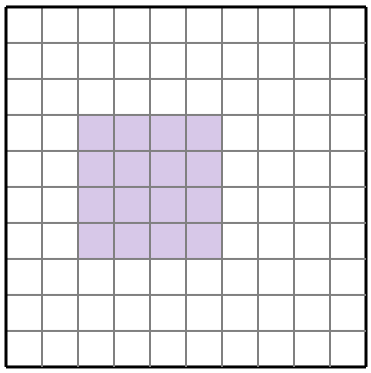

2)

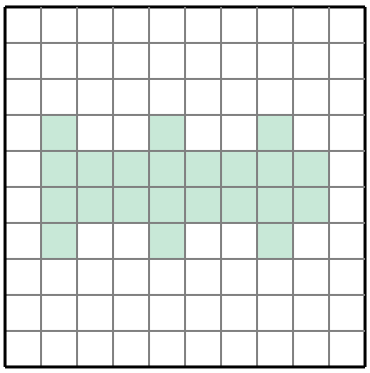

3)

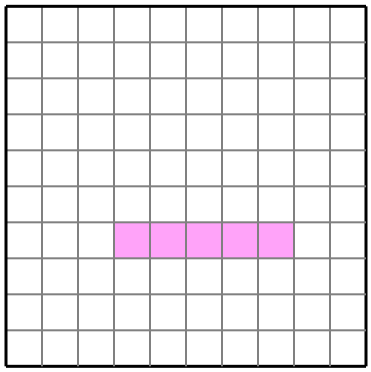

4)

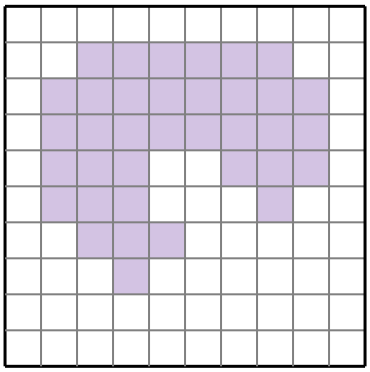

5)

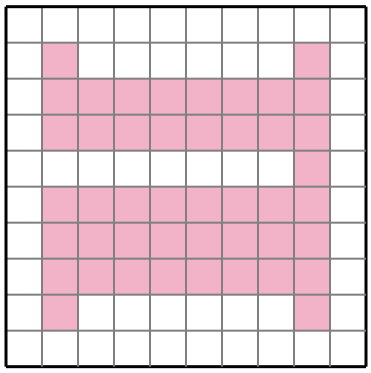

6)

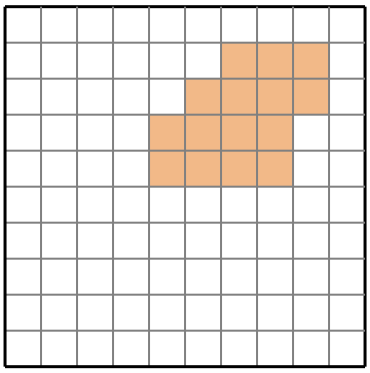

7)

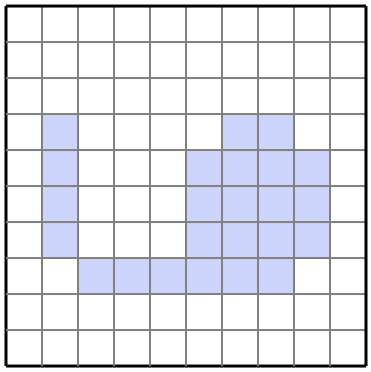

8)

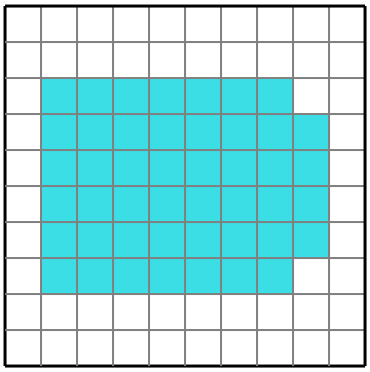

Ответы

1. _____
2. _____
3. _____
4. _____
5. _____
6. _____
7. _____
8. _____

1-8	88	75	63	50	38	25	13	0

Определение периметра

Имя: **Ключ к правильным ответам**

Определите периметр закрашенной фигуры. Каждый блок равен 1 единице (u).

1)

		2	1	1	2				
		1			1				
		1			1				
		2	1	1	2				

2)

	3			3			3		
	1	1	1		1	1		2	
	1	1	1		1	1		2	
	3			3			3		

3)

			3	2	2	2	3		

4)

		2	1	1	1	1	2		
	2							2	
	1			1	1			1	
	1		1			2		2	
	2		1				3		
		2		3					
			3						

5)

	3							3	
	1	1	1	1	1	1	1	1	
	2	1	1	1	1	1	1	1	
								2	
	2	1	1	1	1	1	1	1	
	1							1	
	1	1	1	1	1	1	1	1	
	3							3	

6)

						2	1	2	
					2			2	
				2			1		
				2	1	1	2		

7)

	3					2	2		
	2				2			2	
	2				1			1	
	3				1			2	
		3	2	2	1	1	2		

8)

	2	1	1	1	1	1	2		
	1							2	
	1							1	
	1							1	
	1							2	
	2	1	1	1	1	1	2		

Ответы

1. **16**
2. **32**
3. **12**
4. **36**
5. **50**
6. **18**
7. **34**
8. **28**