Определение длины конкретной стороны Имя:

Определите значение 'L'

1) Площадь = $30u^2$

2) Площадь = $18u^2$

3) Площадь = $8u^2$

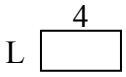

4) Площадь = $40u^2$

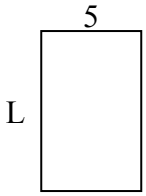

5) Площадь = $56u^2$

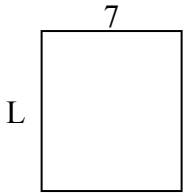

6) Площадь = $60u^2$

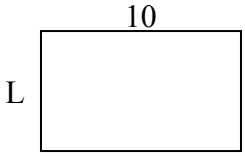

7) Площадь = $36u^2$

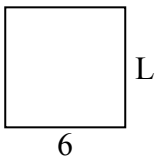

8) Площадь = $20u^2$

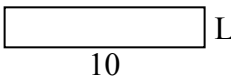

9) Площадь = $48u^2$

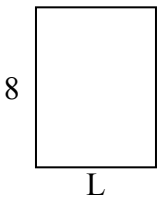

10) Площадь = $9u^2$

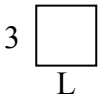

11) Площадь = $42u^2$

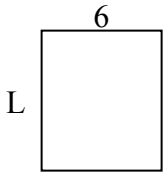

12) Площадь = $36u^2$

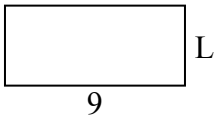

13) Площадь = $16u^2$

14) Площадь = $12u^2$

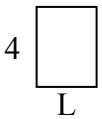

15) Площадь = $90u^2$

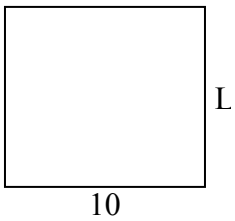

Ответы

1. _____
2. _____
3. _____
4. _____
5. _____
6. _____
7. _____
8. _____
9. _____
10. _____
11. _____
12. _____
13. _____
14. _____
15. _____

1-10	93	87	80	73	67	60	53	47	40	33
11-15	27	20	13	7	0					

Определение длины конкретной стороны

Имя: **Ключ к правильным ответам**

Определите значение 'L'

1) Площадь = $30u^2$

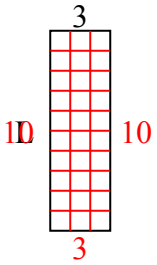

2) Площадь = $18u^2$

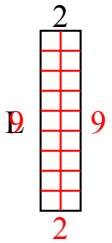

3) Площадь = $8u^2$

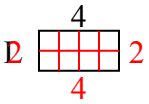

4) Площадь = $40u^2$

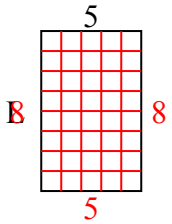

5) Площадь = $56u^2$

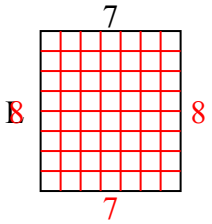

6) Площадь = $60u^2$

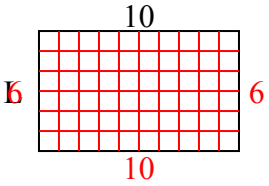

7) Площадь = $36u^2$

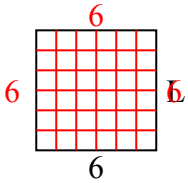

8) Площадь = $20u^2$

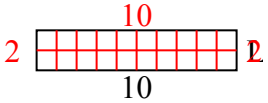

9) Площадь = $48u^2$

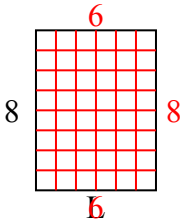

10) Площадь = $9u^2$

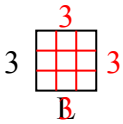

11) Площадь = $42u^2$

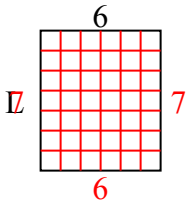

12) Площадь = $36u^2$

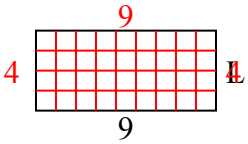

13) Площадь = $16u^2$

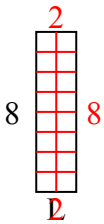

14) Площадь = $12u^2$

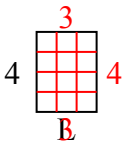

15) Площадь = $90u^2$

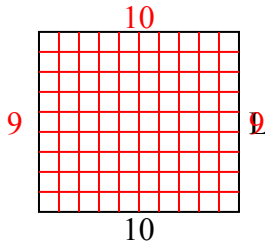

Ответы

1. **10**
2. **9**
3. **2**
4. **8**
5. **8**
6. **6**
7. **6**
8. **2**
9. **6**
10. **3**
11. **7**
12. **4**
13. **2**
14. **3**
15. **9**

1-10	93	87	80	73	67	60	53	47	40	33
11-15	27	20	13	7	0					

Определение длины конкретной стороны Имя:

Определите значение 'L'

1) Площадь = $10u^2$

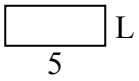

2) Площадь = $40u^2$

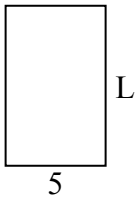

3) Площадь = $64u^2$

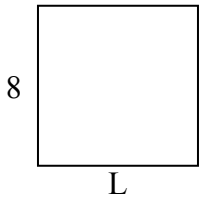

4) Площадь = $36u^2$

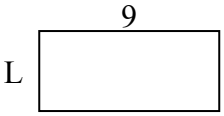

5) Площадь = $12u^2$

6) Площадь = $24u^2$

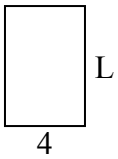

7) Площадь = $12u^2$

8) Площадь = $20u^2$



9) Площадь = $15u^2$

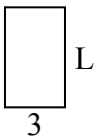

10) Площадь = $8u^2$

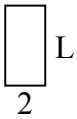

11) Площадь = $10u^2$

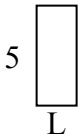

12) Площадь = $63u^2$

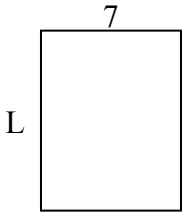

13) Площадь = $28u^2$

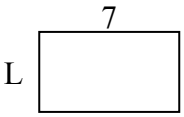

14) Площадь = $12u^2$

15) Площадь = $8u^2$

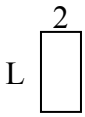

Ответы

1. _____
2. _____
3. _____
4. _____
5. _____
6. _____
7. _____
8. _____
9. _____
10. _____
11. _____
12. _____
13. _____
14. _____
15. _____

1-10	93	87	80	73	67	60	53	47	40	33
11-15	27	20	13	7	0					

Определение длины конкретной стороны Имя: **Ключ к правильным ответам**

Определите значение 'L'

1) Площадь = $10u^2$

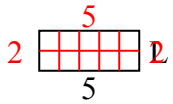

2) Площадь = $40u^2$

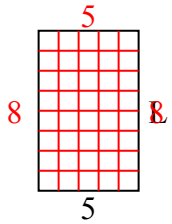

3) Площадь = $64u^2$

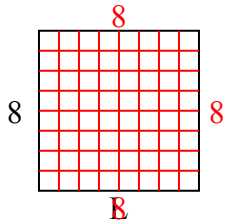

4) Площадь = $36u^2$

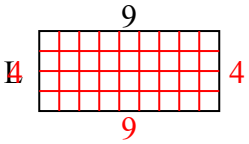

5) Площадь = $12u^2$

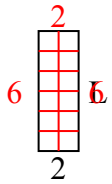

6) Площадь = $24u^2$

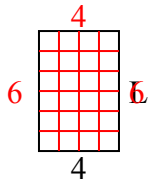

7) Площадь = $12u^2$

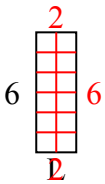

8) Площадь = $20u^2$

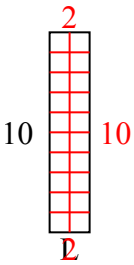

9) Площадь = $15u^2$

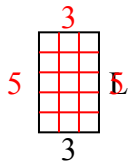

10) Площадь = $8u^2$

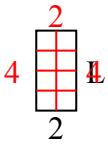

11) Площадь = $10u^2$

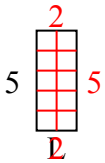

12) Площадь = $63u^2$

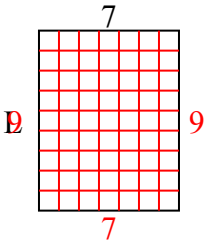

13) Площадь = $28u^2$

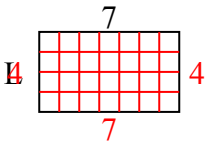

14) Площадь = $12u^2$

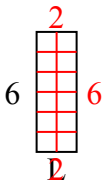

15) Площадь = $8u^2$

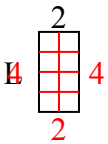

Ответы

1. **2**
2. **8**
3. **8**
4. **4**
5. **6**
6. **6**
7. **2**
8. **2**
9. **5**
10. **4**
11. **2**
12. **9**
13. **4**
14. **2**
15. **4**

1-10	93	87	80	73	67	60	53	47	40	33
11-15	27	20	13	7	0					

Определение длины конкретной стороны Имя:

Определите значение 'L'

1) Площадь = $70u^2$

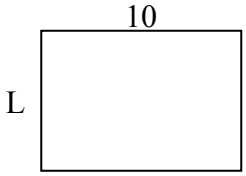

2) Площадь = $42u^2$

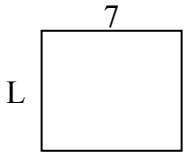

3) Площадь = $18u^2$

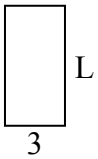

4) Площадь = $80u^2$

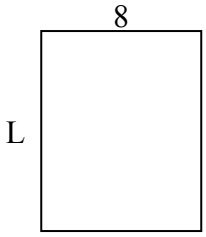

5) Площадь = $18u^2$

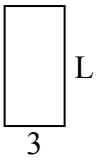

6) Площадь = $40u^2$

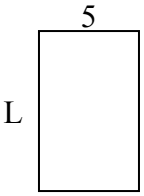

7) Площадь = $24u^2$

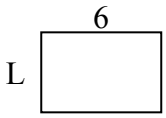

8) Площадь = $60u^2$

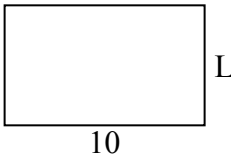

9) Площадь = $81u^2$

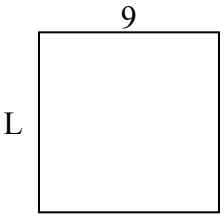

10) Площадь = $30u^2$

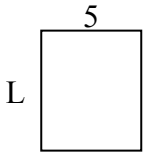

11) Площадь = $9u^2$

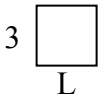

12) Площадь = $18u^2$

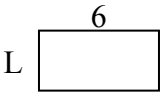

13) Площадь = $45u^2$

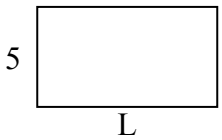

14) Площадь = $32u^2$

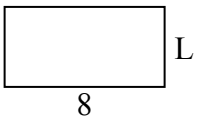

15) Площадь = $56u^2$

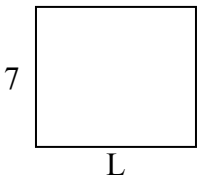

Ответы

1. _____
2. _____
3. _____
4. _____
5. _____
6. _____
7. _____
8. _____
9. _____
10. _____
11. _____
12. _____
13. _____
14. _____
15. _____

1-10	93	87	80	73	67	60	53	47	40	33
11-15	27	20	13	7	0					

Определение длины конкретной стороны Имя: **Ключ к правильным ответам**

Определите значение 'L'

1) Площадь = $70u^2$

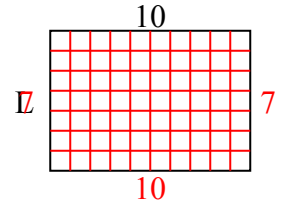

2) Площадь = $42u^2$

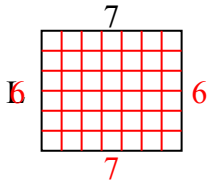

3) Площадь = $18u^2$

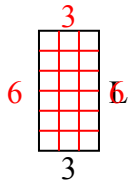

4) Площадь = $80u^2$

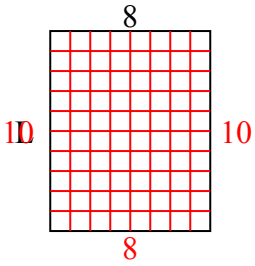

5) Площадь = $18u^2$

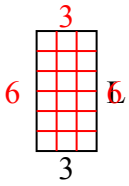

6) Площадь = $40u^2$

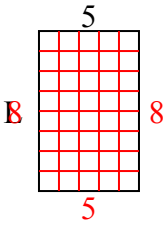

7) Площадь = $24u^2$

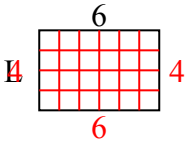

8) Площадь = $60u^2$

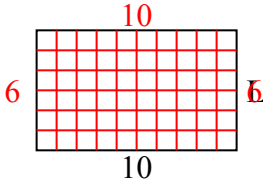

9) Площадь = $81u^2$

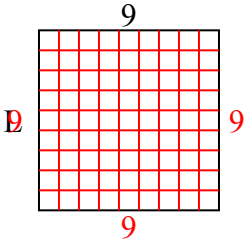

10) Площадь = $30u^2$

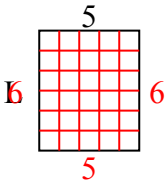

11) Площадь = $9u^2$

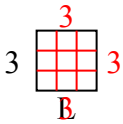

12) Площадь = $18u^2$

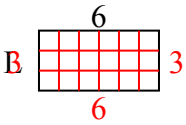

13) Площадь = $45u^2$

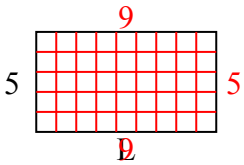

14) Площадь = $32u^2$

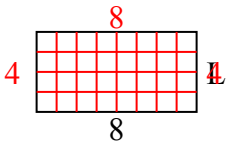

15) Площадь = $56u^2$

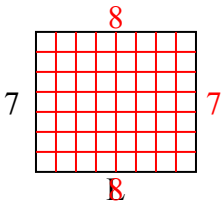

Ответы

1. **7**
2. **6**
3. **6**
4. **10**
5. **6**
6. **8**
7. **4**
8. **6**
9. **9**
10. **6**
11. **3**
12. **3**
13. **9**
14. **4**
15. **8**

1-10	93	87	80	73	67	60	53	47	40	33
11-15	27	20	13	7	0					

Определение длины конкретной стороны Имя:

Определите значение 'L'

1) Площадь = $12u^2$

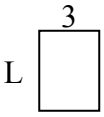

2) Площадь = $30u^2$

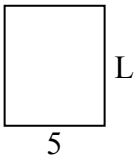

3) Площадь = $56u^2$

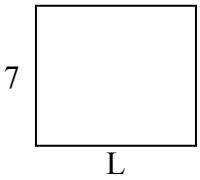

4) Площадь = $20u^2$

5) Площадь = $42u^2$

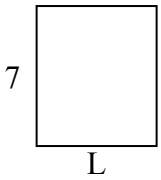

6) Площадь = $15u^2$

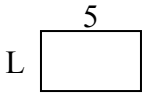

7) Площадь = $12u^2$

8) Площадь = $60u^2$



9) Площадь = $36u^2$



10) Площадь = $20u^2$

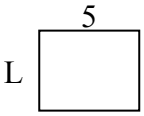

11) Площадь = $12u^2$

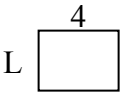

12) Площадь = $32u^2$

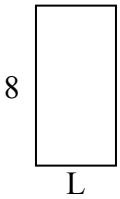

13) Площадь = $16u^2$

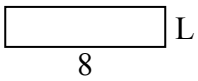

14) Площадь = $20u^2$

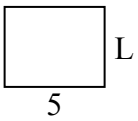

15) Площадь = $48u^2$

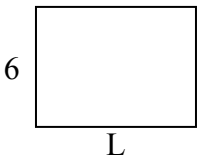

Ответы

1. _____
2. _____
3. _____
4. _____
5. _____
6. _____
7. _____
8. _____
9. _____
10. _____
11. _____
12. _____
13. _____
14. _____
15. _____

1-10	93	87	80	73	67	60	53	47	40	33
11-15	27	20	13	7	0					

Определение длины конкретной стороны Имя: **Ключ к правильным ответам**

Определите значение 'L'

1) Площадь = $12u^2$

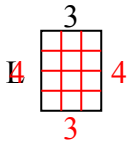

2) Площадь = $30u^2$

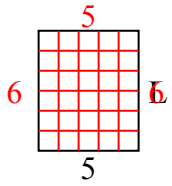

3) Площадь = $56u^2$

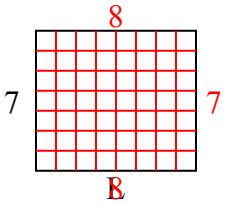

4) Площадь = $20u^2$

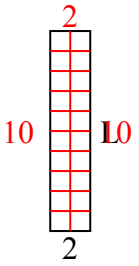

5) Площадь = $42u^2$

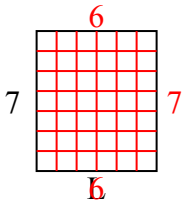

6) Площадь = $15u^2$

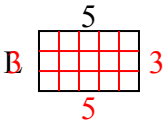

7) Площадь = $12u^2$

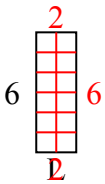

8) Площадь = $60u^2$

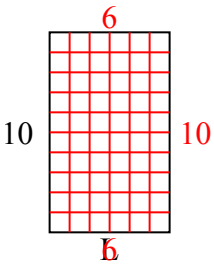

9) Площадь = $36u^2$

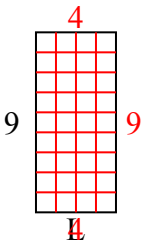

10) Площадь = $20u^2$

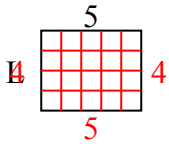

11) Площадь = $12u^2$

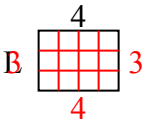

12) Площадь = $32u^2$

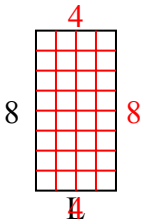

13) Площадь = $16u^2$

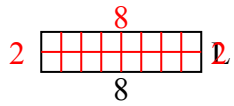

14) Площадь = $20u^2$

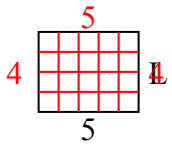

15) Площадь = $48u^2$

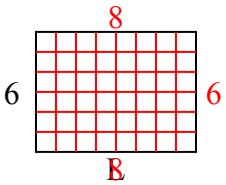

Ответы

1. **4**
2. **6**
3. **8**
4. **10**
5. **6**
6. **3**
7. **2**
8. **6**
9. **4**
10. **4**
11. **3**
12. **4**
13. **2**
14. **4**
15. **8**

1-10	93	87	80	73	67	60	53	47	40	33
11-15	27	20	13	7	0					

Определение длины конкретной стороны Имя:

Определите значение 'L'

1) Площадь = $28u^2$

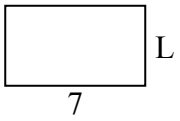

2) Площадь = $21u^2$

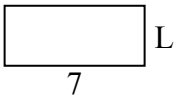

3) Площадь = $30u^2$

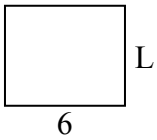

4) Площадь = $12u^2$

5) Площадь = $48u^2$

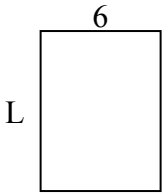

6) Площадь = $6u^2$

7) Площадь = $18u^2$



8) Площадь = $28u^2$

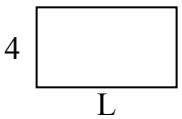

9) Площадь = $30u^2$

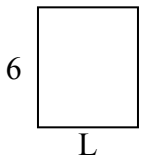

10) Площадь = $72u^2$

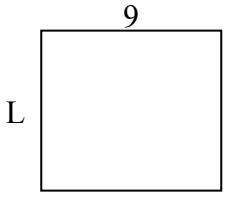

11) Площадь = $30u^2$

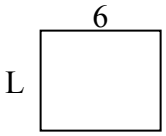

12) Площадь = $90u^2$

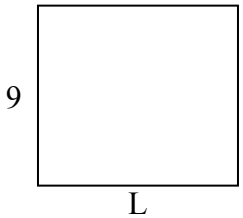

13) Площадь = $30u^2$

14) Площадь = $56u^2$

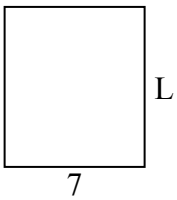

15) Площадь = $54u^2$

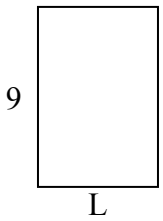

Ответы

1. _____
2. _____
3. _____
4. _____
5. _____
6. _____
7. _____
8. _____
9. _____
10. _____
11. _____
12. _____
13. _____
14. _____
15. _____

1-10	93	87	80	73	67	60	53	47	40	33
11-15	27	20	13	7	0					

Определение длины конкретной стороны Имя: **Ключ к правильным ответам**

Определите значение 'L'

1) Площадь = $28u^2$

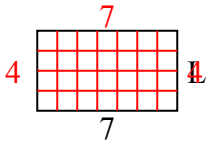

2) Площадь = $21u^2$

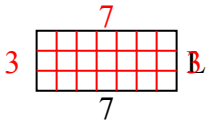

3) Площадь = $30u^2$

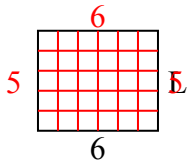

4) Площадь = $12u^2$

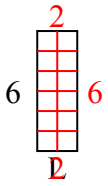

5) Площадь = $48u^2$

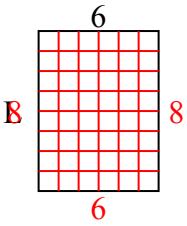

6) Площадь = $6u^2$

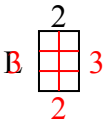

7) Площадь = $18u^2$

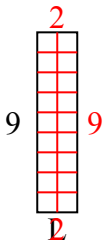

8) Площадь = $28u^2$

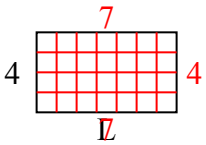

9) Площадь = $30u^2$

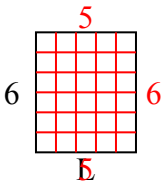

10) Площадь = $72u^2$

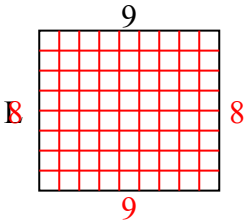

11) Площадь = $30u^2$

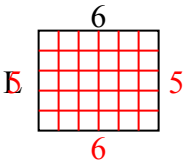

12) Площадь = $90u^2$

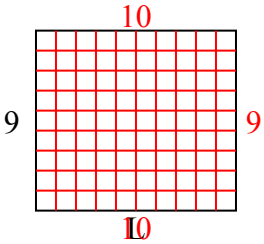

13) Площадь = $30u^2$

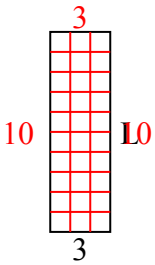

14) Площадь = $56u^2$

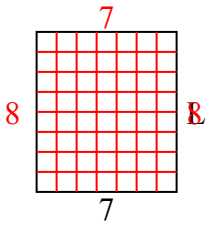

15) Площадь = $54u^2$

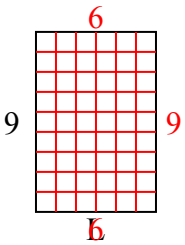

Ответы

1. **4**
2. **3**
3. **5**
4. **2**
5. **8**
6. **3**
7. **2**
8. **7**
9. **5**
10. **8**
11. **5**
12. **10**
13. **10**
14. **8**
15. **6**

1-10	93	87	80	73	67	60	53	47	40	33
11-15	27	20	13	7	0					

Определение длины конкретной стороны Имя:

Определите значение 'L'

1) Площадь = $30u^2$

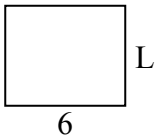

2) Площадь = $90u^2$

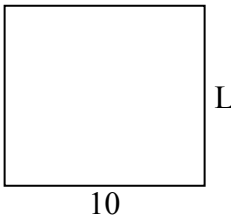

3) Площадь = $10u^2$

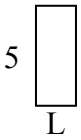

4) Площадь = $14u^2$

5) Площадь = $24u^2$

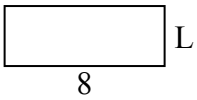

6) Площадь = $18u^2$

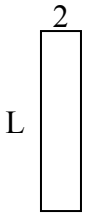

7) Площадь = $49u^2$

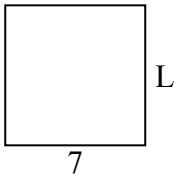

8) Площадь = $90u^2$

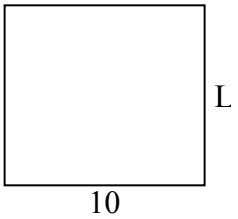

9) Площадь = $48u^2$

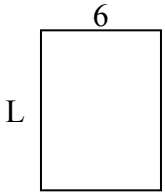

10) Площадь = $63u^2$

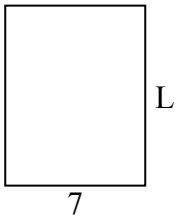

11) Площадь = $48u^2$

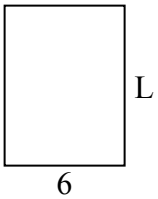

12) Площадь = $20u^2$

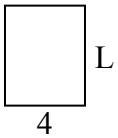

13) Площадь = $24u^2$

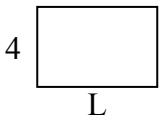

14) Площадь = $16u^2$

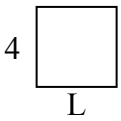

15) Площадь = $30u^2$

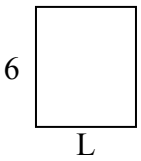

Ответы

1. _____
2. _____
3. _____
4. _____
5. _____
6. _____
7. _____
8. _____
9. _____
10. _____
11. _____
12. _____
13. _____
14. _____
15. _____

1-10	93	87	80	73	67	60	53	47	40	33
11-15	27	20	13	7	0					

Определение длины конкретной стороны Имя: **Ключ к правильным ответам**

Определите значение 'L'

1) Площадь = $30u^2$

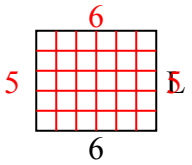

2) Площадь = $90u^2$

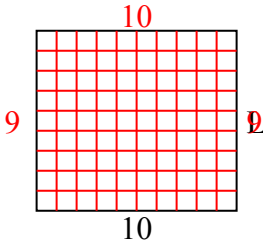

3) Площадь = $10u^2$

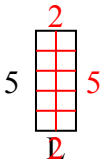

4) Площадь = $14u^2$

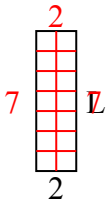

5) Площадь = $24u^2$

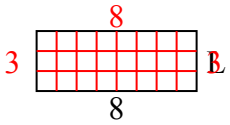

6) Площадь = $18u^2$

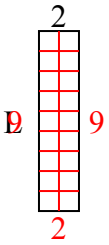

7) Площадь = $49u^2$

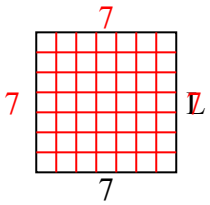

8) Площадь = $90u^2$

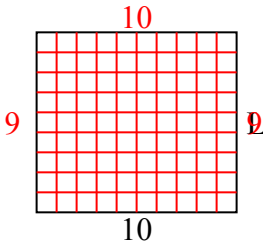

9) Площадь = $48u^2$

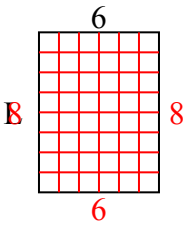

10) Площадь = $63u^2$

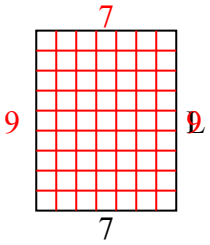

11) Площадь = $48u^2$

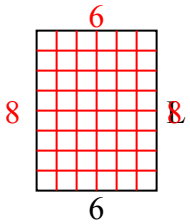

12) Площадь = $20u^2$

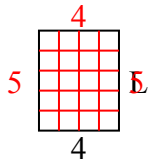

13) Площадь = $24u^2$

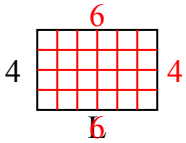

14) Площадь = $16u^2$

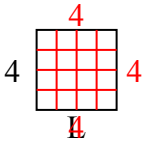

15) Площадь = $30u^2$

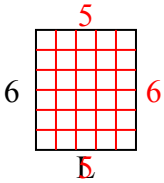

Ответы

1. **5**
2. **9**
3. **2**
4. **7**
5. **3**
6. **9**
7. **7**
8. **9**
9. **8**
10. **9**
11. **8**
12. **5**
13. **6**
14. **4**
15. **5**

1-10	93	87	80	73	67	60	53	47	40	33
11-15	27	20	13	7	0					

Определение длины конкретной стороны Имя:

Определите значение 'L'

1) Площадь = $18u^2$

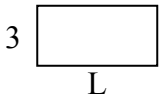

2) Площадь = $72u^2$

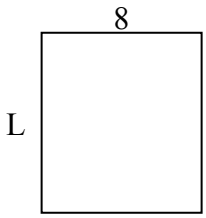

3) Площадь = $12u^2$

4) Площадь = $56u^2$

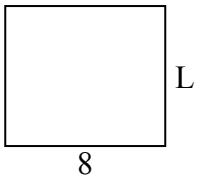

5) Площадь = $6u^2$

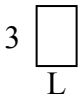

6) Площадь = $50u^2$

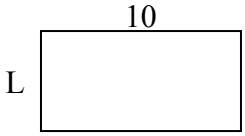

7) Площадь = $56u^2$

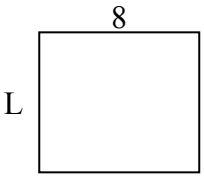

8) Площадь = $27u^2$

9) Площадь = $54u^2$

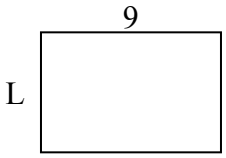

10) Площадь = $81u^2$

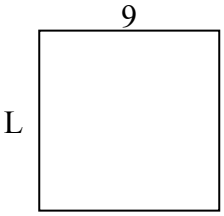

11) Площадь = $12u^2$

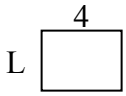

12) Площадь = $28u^2$

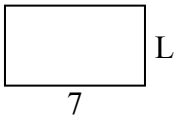

13) Площадь = $15u^2$

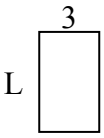

14) Площадь = $20u^2$



15) Площадь = $18u^2$

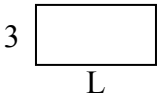

Ответы

1. _____
2. _____
3. _____
4. _____
5. _____
6. _____
7. _____
8. _____
9. _____
10. _____
11. _____
12. _____
13. _____
14. _____
15. _____

1-10	93	87	80	73	67	60	53	47	40	33
11-15	27	20	13	7	0					

Определение длины конкретной стороны Имя: Ключ к правильным ответам

Определите значение 'L'

1) Площадь = $18u^2$

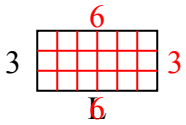

2) Площадь = $72u^2$

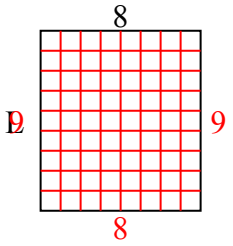

3) Площадь = $12u^2$

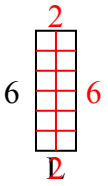

4) Площадь = $56u^2$

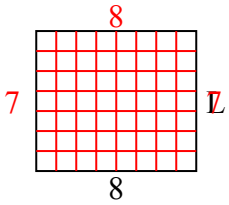

5) Площадь = $6u^2$

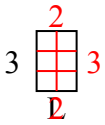

6) Площадь = $50u^2$

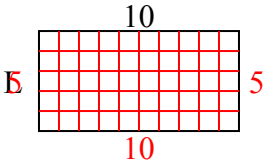

7) Площадь = $56u^2$

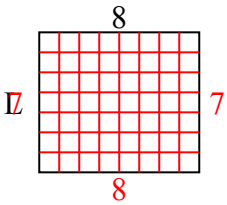

8) Площадь = $27u^2$

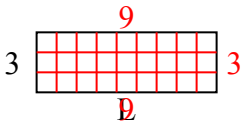

9) Площадь = $54u^2$

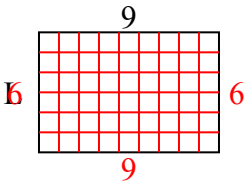

10) Площадь = $81u^2$

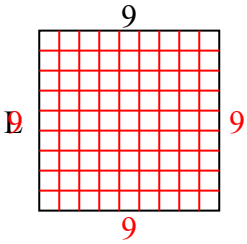

11) Площадь = $12u^2$

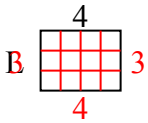

12) Площадь = $28u^2$

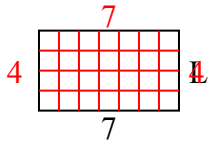

13) Площадь = $15u^2$

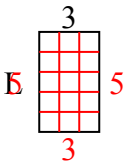

14) Площадь = $20u^2$

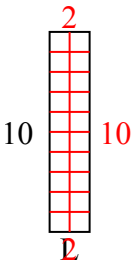

15) Площадь = $18u^2$

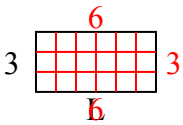

Ответы

1. 6
2. 9
3. 2
4. 7
5. 2
6. 5
7. 7
8. 9
9. 6
10. 9
11. 3
12. 4
13. 5
14. 2
15. 6

1-10	93	87	80	73	67	60	53	47	40	33
11-15	27	20	13	7	0					

Определение длины конкретной стороны Имя:

Определите значение 'L'

1) Площадь = $30u^2$

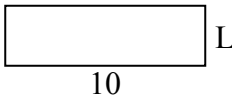

2) Площадь = $24u^2$

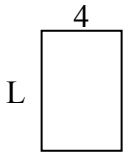

3) Площадь = $56u^2$

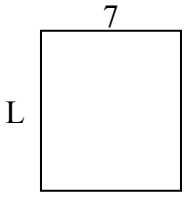

4) Площадь = $35u^2$

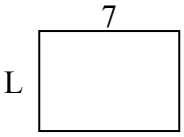

5) Площадь = $16u^2$

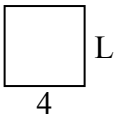

6) Площадь = $81u^2$

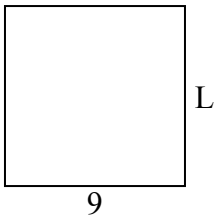

7) Площадь = $90u^2$

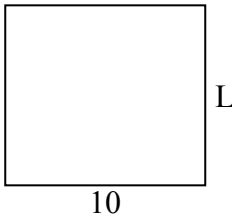

8) Площадь = $80u^2$

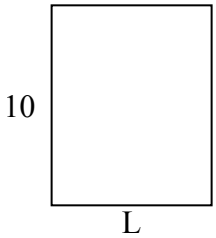

9) Площадь = $27u^2$

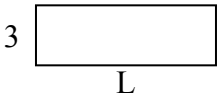

10) Площадь = $32u^2$



11) Площадь = $27u^2$

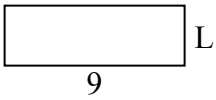

12) Площадь = $14u^2$



13) Площадь = $20u^2$

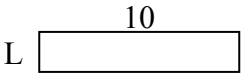

14) Площадь = $63u^2$

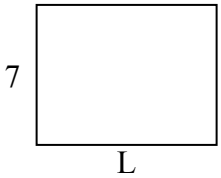

15) Площадь = $18u^2$

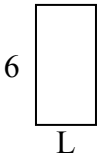

Ответы

1. _____
2. _____
3. _____
4. _____
5. _____
6. _____
7. _____
8. _____
9. _____
10. _____
11. _____
12. _____
13. _____
14. _____
15. _____

1-10	93	87	80	73	67	60	53	47	40	33
11-15	27	20	13	7	0					

Определение длины конкретной стороны Имя: **Ключ к правильным ответам**

Определите значение 'L'

1) Площадь = $30u^2$

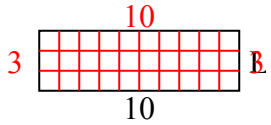

2) Площадь = $24u^2$

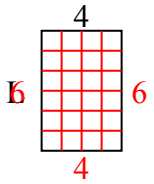

3) Площадь = $56u^2$

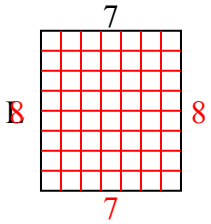

4) Площадь = $35u^2$

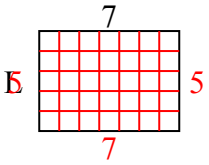

5) Площадь = $16u^2$

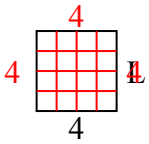

6) Площадь = $81u^2$

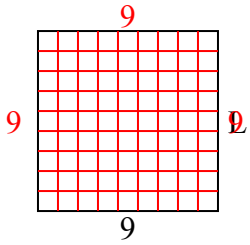

7) Площадь = $90u^2$

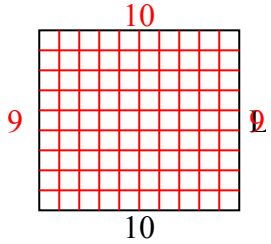

8) Площадь = $80u^2$

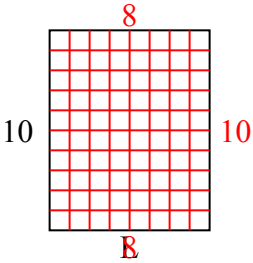

9) Площадь = $27u^2$

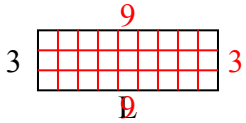

10) Площадь = $32u^2$

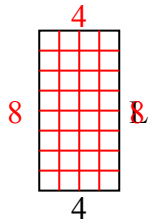

11) Площадь = $27u^2$

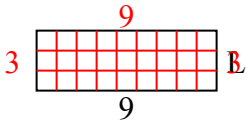

12) Площадь = $14u^2$

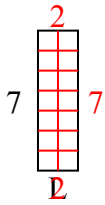

13) Площадь = $20u^2$

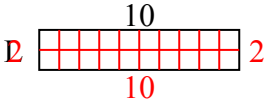

14) Площадь = $63u^2$

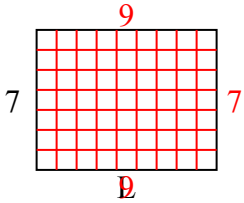

15) Площадь = $18u^2$

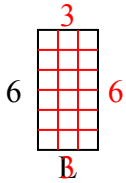

Ответы

1. **3**
2. **6**
3. **8**
4. **5**
5. **4**
6. **9**
7. **9**
8. **8**
9. **9**
10. **8**
11. **3**
12. **2**
13. **2**
14. **9**
15. **3**

1-10	93	87	80	73	67	60	53	47	40	33
11-15	27	20	13	7	0					

Определение длины конкретной стороны Имя:

Определите значение 'L'

1) Площадь = $8u^2$

2) Площадь = $36u^2$

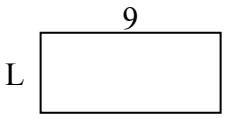

3) Площадь = $14u^2$

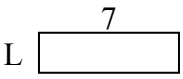

4) Площадь = $63u^2$

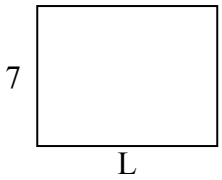

5) Площадь = $8u^2$

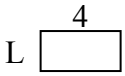

6) Площадь = $60u^2$

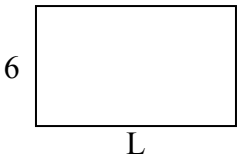

7) Площадь = $45u^2$

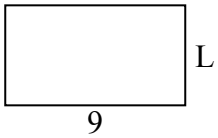

8) Площадь = $20u^2$

9) Площадь = $36u^2$

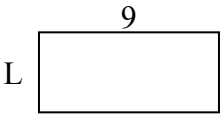

10) Площадь = $48u^2$

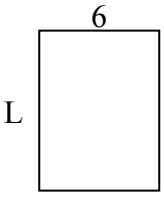

11) Площадь = $15u^2$

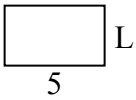

12) Площадь = $63u^2$

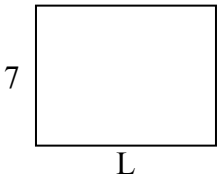

13) Площадь = $20u^2$

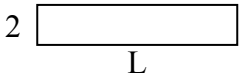

14) Площадь = $18u^2$

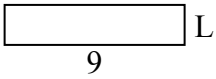

15) Площадь = $36u^2$



Ответы

1. _____
2. _____
3. _____
4. _____
5. _____
6. _____
7. _____
8. _____
9. _____
10. _____
11. _____
12. _____
13. _____
14. _____
15. _____

1-10	93	87	80	73	67	60	53	47	40	33
11-15	27	20	13	7	0					

Определение длины конкретной стороны Имя: **Ключ к правильным ответам**

Определите значение 'L'

1) Площадь = $8u^2$

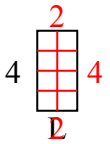

2) Площадь = $36u^2$

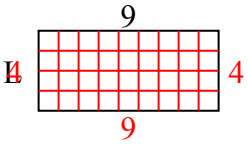

3) Площадь = $14u^2$

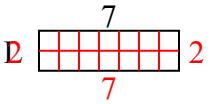

4) Площадь = $63u^2$

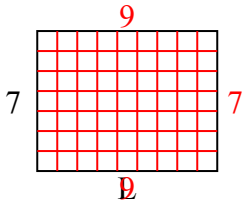

5) Площадь = $8u^2$

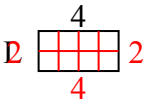

6) Площадь = $60u^2$

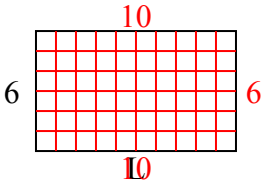

7) Площадь = $45u^2$

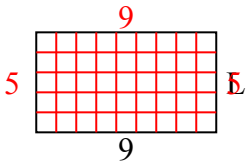

8) Площадь = $20u^2$

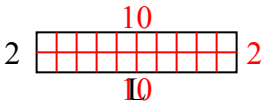

9) Площадь = $36u^2$

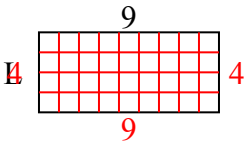

10) Площадь = $48u^2$

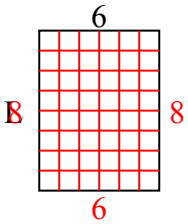

11) Площадь = $15u^2$

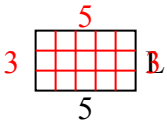

12) Площадь = $63u^2$

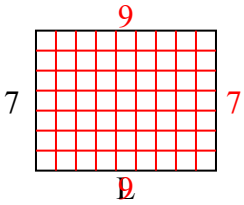

13) Площадь = $20u^2$

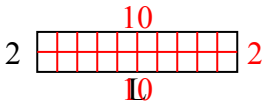

14) Площадь = $18u^2$

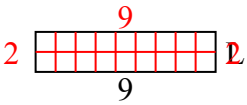

15) Площадь = $36u^2$

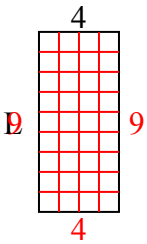

Ответы

1. **2**
2. **4**
3. **2**
4. **9**
5. **2**
6. **10**
7. **5**
8. **10**
9. **4**
10. **8**
11. **3**
12. **9**
13. **10**
14. **2**
15. **9**

1-10	93	87	80	73	67	60	53	47	40	33
11-15	27	20	13	7	0					

Определение длины конкретной стороны Имя:

Определите значение 'L'

1) Площадь = $36u^2$

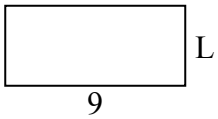

2) Площадь = $10u^2$

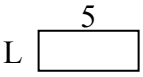

3) Площадь = $14u^2$



4) Площадь = $24u^2$

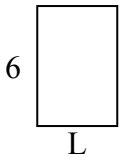

5) Площадь = $50u^2$

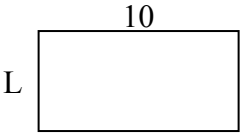

6) Площадь = $6u^2$

7) Площадь = $72u^2$

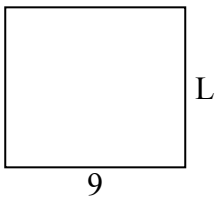

8) Площадь = $27u^2$

9) Площадь = $70u^2$

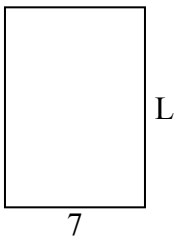

10) Площадь = $72u^2$

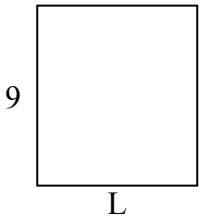

11) Площадь = $16u^2$

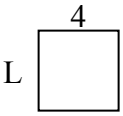

12) Площадь = $24u^2$

13) Площадь = $14u^2$

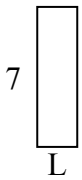

14) Площадь = $80u^2$

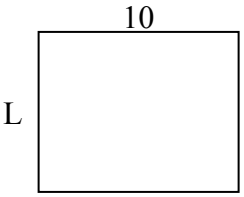

15) Площадь = $27u^2$



Ответы

1. _____
2. _____
3. _____
4. _____
5. _____
6. _____
7. _____
8. _____
9. _____
10. _____
11. _____
12. _____
13. _____
14. _____
15. _____

1-10	93	87	80	73	67	60	53	47	40	33
11-15	27	20	13	7	0					

Определение длины конкретной стороны Имя: **Ключ к правильным ответам**

Определите значение 'L'

1) Площадь = $36u^2$

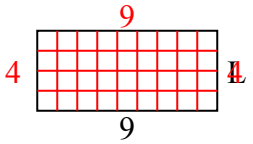

2) Площадь = $10u^2$

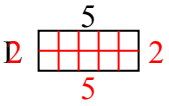

3) Площадь = $14u^2$

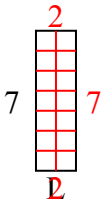

4) Площадь = $24u^2$

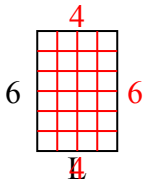

5) Площадь = $50u^2$

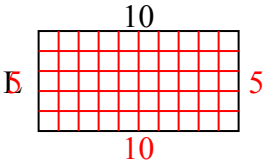

6) Площадь = $6u^2$

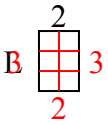

7) Площадь = $72u^2$

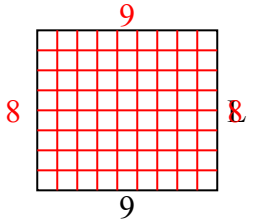

8) Площадь = $27u^2$

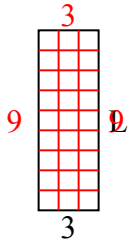

9) Площадь = $70u^2$

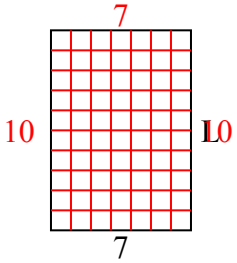

10) Площадь = $72u^2$

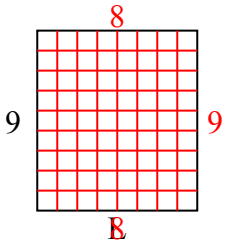

11) Площадь = $16u^2$

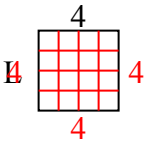

12) Площадь = $24u^2$

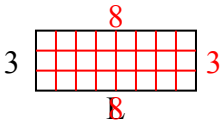

13) Площадь = $14u^2$

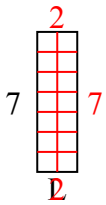

14) Площадь = $80u^2$

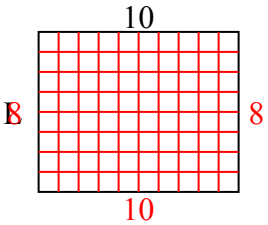

15) Площадь = $27u^2$

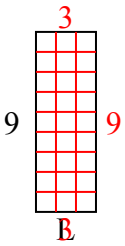

Ответы

1.	4
2.	2
3.	2
4.	4
5.	5
6.	3
7.	8
8.	9
9.	10
10.	8
11.	4
12.	8
13.	2
14.	8
15.	3

1-10	93	87	80	73	67	60	53	47	40	33
11-15	27	20	13	7	0					