Определение длины конкретной стороны Имя:

Определите значение 'L'

1) Площадь = $18u^2$

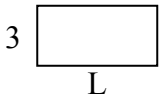

2) Площадь = $72u^2$

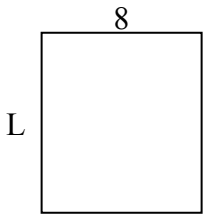

3) Площадь = $12u^2$

4) Площадь = $56u^2$

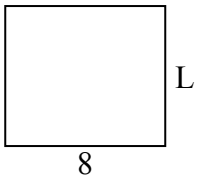

5) Площадь = $6u^2$

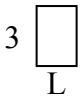

6) Площадь = $50u^2$

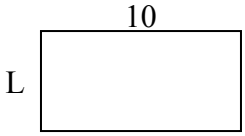

7) Площадь = $56u^2$

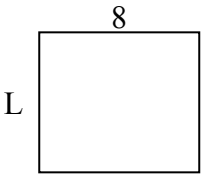

8) Площадь = $27u^2$

9) Площадь = $54u^2$

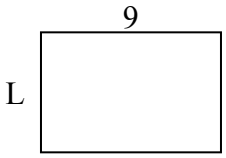

10) Площадь = $81u^2$

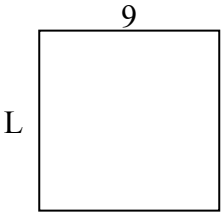

11) Площадь = $12u^2$

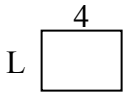

12) Площадь = $28u^2$

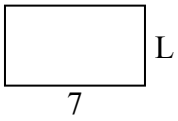

13) Площадь = $15u^2$

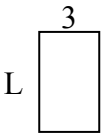

14) Площадь = $20u^2$



15) Площадь = $18u^2$

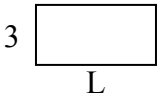

Ответы

1. _____
2. _____
3. _____
4. _____
5. _____
6. _____
7. _____
8. _____
9. _____
10. _____
11. _____
12. _____
13. _____
14. _____
15. _____

1-10	93	87	80	73	67	60	53	47	40	33
11-15	27	20	13	7	0					

Определение длины конкретной стороны Имя: Ключ к правильным ответам

Определите значение 'L'

1) Площадь = $18u^2$

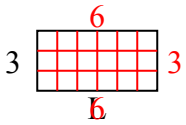

2) Площадь = $72u^2$

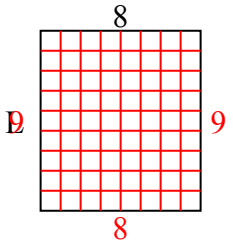

3) Площадь = $12u^2$

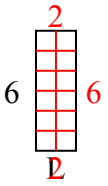

4) Площадь = $56u^2$

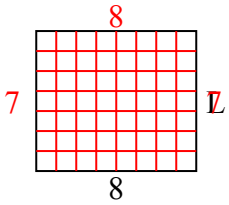

5) Площадь = $6u^2$

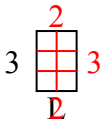

6) Площадь = $50u^2$

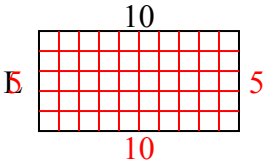

7) Площадь = $56u^2$

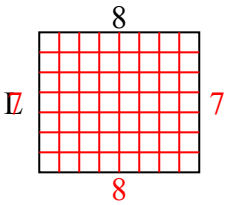

8) Площадь = $27u^2$

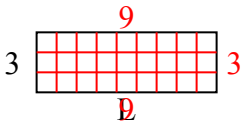

9) Площадь = $54u^2$

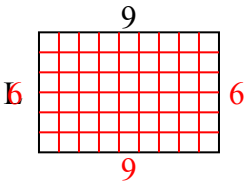

10) Площадь = $81u^2$

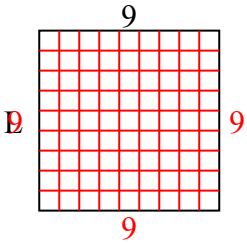

11) Площадь = $12u^2$

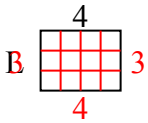

12) Площадь = $28u^2$

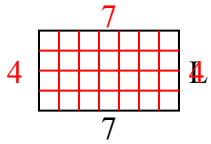

13) Площадь = $15u^2$

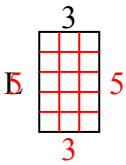

14) Площадь = $20u^2$

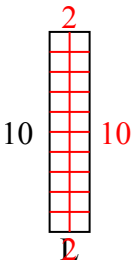

15) Площадь = $18u^2$

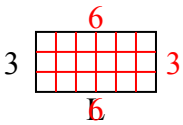

Ответы

1. 6
2. 9
3. 2
4. 7
5. 2
6. 5
7. 7
8. 9
9. 6
10. 9
11. 3
12. 4
13. 5
14. 2
15. 6

1-10	93	87	80	73	67	60	53	47	40	33
11-15	27	20	13	7	0					