Определение длины конкретной стороны Имя:

Определите значение 'L'

1) Площадь = $10u^2$

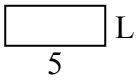

2) Площадь = $40u^2$

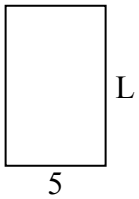

3) Площадь = $64u^2$

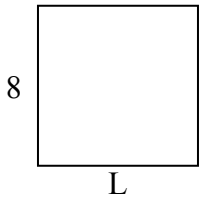

4) Площадь = $36u^2$

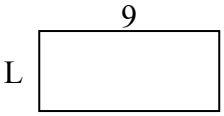

5) Площадь = $12u^2$

6) Площадь = $24u^2$

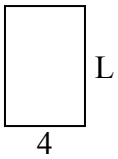

7) Площадь = $12u^2$

8) Площадь = $20u^2$



9) Площадь = $15u^2$

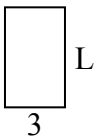

10) Площадь = $8u^2$

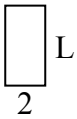

11) Площадь = $10u^2$

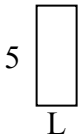

12) Площадь = $63u^2$

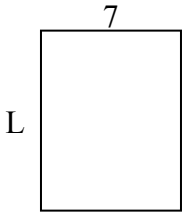

13) Площадь = $28u^2$

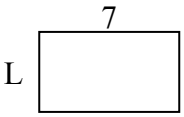

14) Площадь = $12u^2$

15) Площадь = $8u^2$

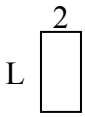

Ответы

1. _____
2. _____
3. _____
4. _____
5. _____
6. _____
7. _____
8. _____
9. _____
10. _____
11. _____
12. _____
13. _____
14. _____
15. _____

1-10	93	87	80	73	67	60	53	47	40	33
11-15	27	20	13	7	0					

Определение длины конкретной стороны Имя: **Ключ к правильным ответам**

Определите значение 'L'

1) Площадь = $10u^2$

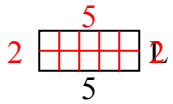

2) Площадь = $40u^2$

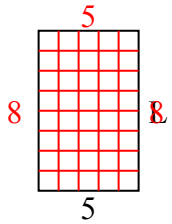

3) Площадь = $64u^2$

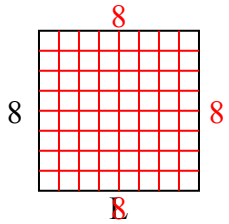

4) Площадь = $36u^2$

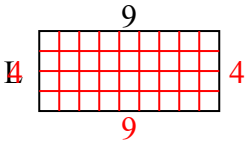

5) Площадь = $12u^2$

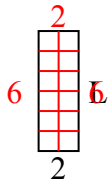

6) Площадь = $24u^2$

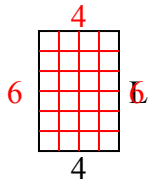

7) Площадь = $12u^2$

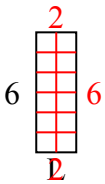

8) Площадь = $20u^2$

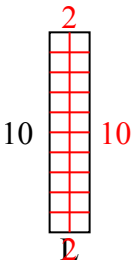

9) Площадь = $15u^2$

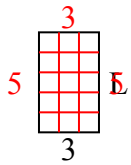

10) Площадь = $8u^2$

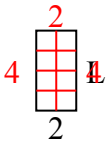

11) Площадь = $10u^2$

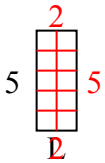

12) Площадь = $63u^2$

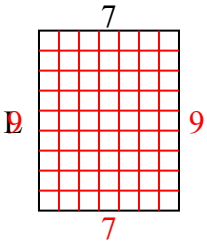

13) Площадь = $28u^2$

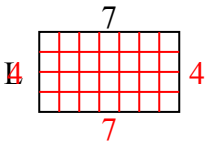

14) Площадь = $12u^2$

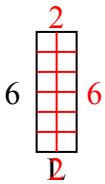

15) Площадь = $8u^2$

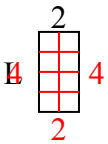

Ответы

1. **2**
2. **8**
3. **8**
4. **4**
5. **6**
6. **6**
7. **2**
8. **2**
9. **5**
10. **4**
11. **2**
12. **9**
13. **4**
14. **2**
15. **4**

1-10	93	87	80	73	67	60	53	47	40	33
11-15	27	20	13	7	0					