Определение длины конкретной стороны Имя:

Определите значение 'L'

1) Площадь = $36u^2$

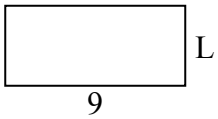

2) Площадь = $10u^2$

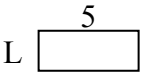

3) Площадь = $14u^2$



4) Площадь = $24u^2$

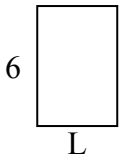

5) Площадь = $50u^2$

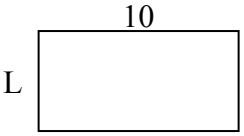

6) Площадь = $6u^2$

7) Площадь = $72u^2$

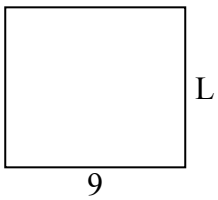

8) Площадь = $27u^2$

9) Площадь = $70u^2$

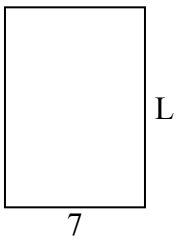

10) Площадь = $72u^2$

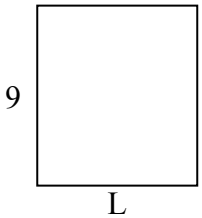

11) Площадь = $16u^2$

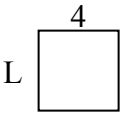

12) Площадь = $24u^2$

13) Площадь = $14u^2$

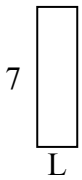

14) Площадь = $80u^2$

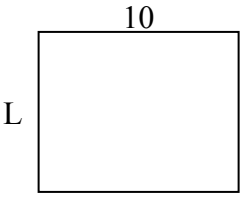

15) Площадь = $27u^2$



Ответы

1. _____
2. _____
3. _____
4. _____
5. _____
6. _____
7. _____
8. _____
9. _____
10. _____
11. _____
12. _____
13. _____
14. _____
15. _____

1-10	93	87	80	73	67	60	53	47	40	33
11-15	27	20	13	7	0					

Определение длины конкретной стороны Имя: **Ключ к правильным ответам**

Определите значение 'L'

1) Площадь = $36u^2$

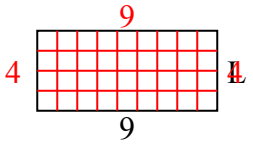

2) Площадь = $10u^2$

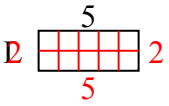

3) Площадь = $14u^2$

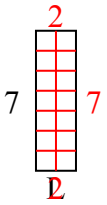

4) Площадь = $24u^2$

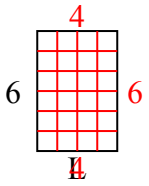

5) Площадь = $50u^2$

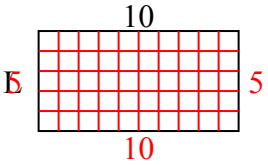

6) Площадь = $6u^2$

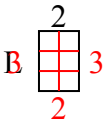

7) Площадь = $72u^2$

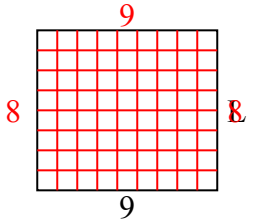

8) Площадь = $27u^2$

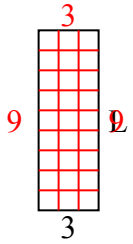

9) Площадь = $70u^2$

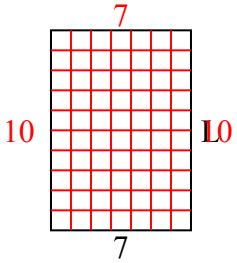

10) Площадь = $72u^2$

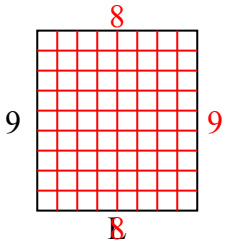

11) Площадь = $16u^2$

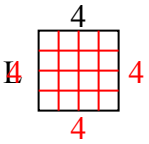

12) Площадь = $24u^2$

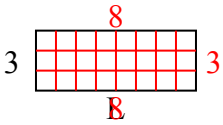

13) Площадь = $14u^2$

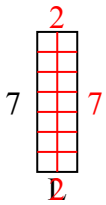

14) Площадь = $80u^2$

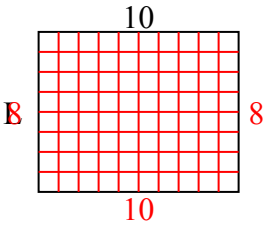

15) Площадь = $27u^2$

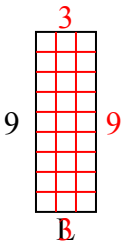

Ответы

1.	4
2.	2
3.	2
4.	4
5.	5
6.	3
7.	8
8.	9
9.	10
10.	8
11.	4
12.	8
13.	2
14.	8
15.	3

1-10	93	87	80	73	67	60	53	47	40	33
11-15	27	20	13	7	0					