Определите актуальную ширину, высоту и площадь каждого прямоугольника. Округлите площадь до целого числа.

1)

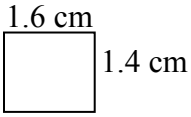

1 cm = 3 ft

2)

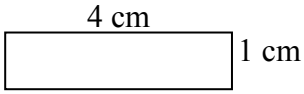

1 cm = 3 ft

3)

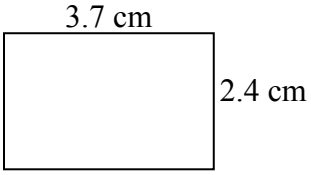

1 cm = 10 ft

4)

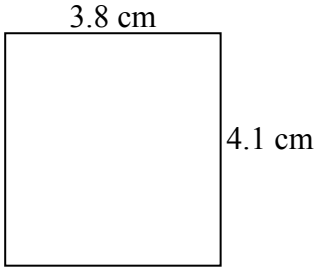

1 cm = 5 ft

5)

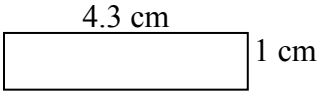

1 cm = 9 ft

6)

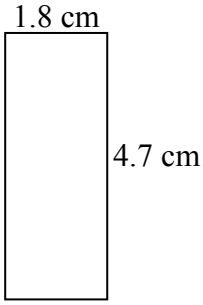

1 cm = 5 ft

7)

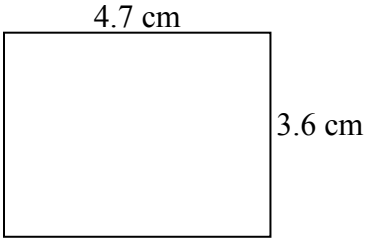

1 cm = 10 ft

8)

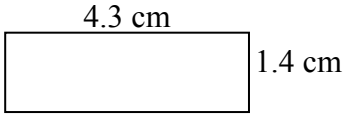

1 cm = 9 ft

Ответы

1. _____ _____ _____
2. _____ _____ _____
3. _____ _____ _____
4. _____ _____ _____
5. _____ _____ _____
6. _____ _____ _____
7. _____ _____ _____
8. _____ _____ _____

1-8	88	75	63	50	38	25	13	0

Определите актуальную ширину, высоту и площадь каждого прямоугольника. Округлите площадь до целого числа.

1)

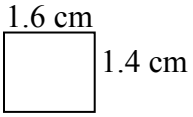

1 cm = 3 ft

2)

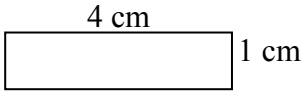

1 cm = 3 ft

3)

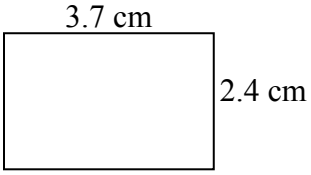

1 cm = 10 ft

4)

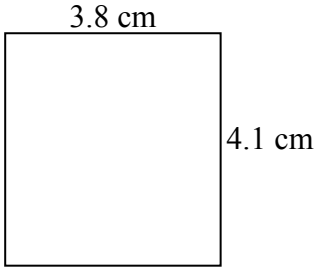

1 cm = 5 ft

5)

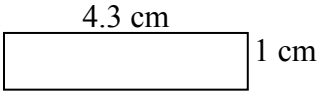

1 cm = 9 ft

6)

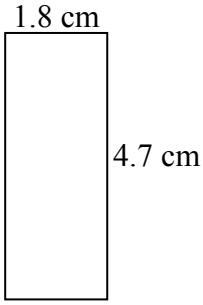

1 cm = 5 ft

7)

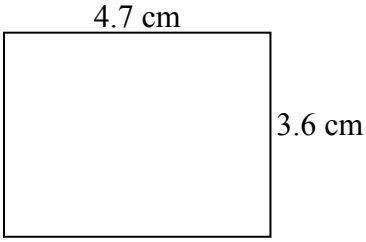

1 cm = 10 ft

8)

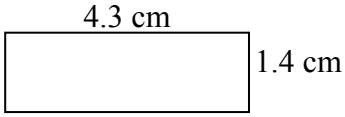

1 cm = 9 ft

Ответы

1.	4.8	4.2	20
2.	12	3	36
3.	37	24	888
4.	19	20.5	390
5.	38.7	9	348
6.	9	23.5	212
7.	47	36	1 692
8.	38.7	12.6	488

1-8	88	75	63	50	38	25	13	0