Определение площади по секторам Имя:

Определите площадь прямоугольников, разбивая на сектора. Первый уже разбит.

1)

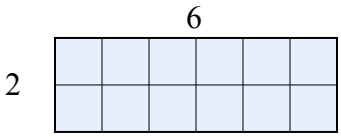

2)



3)

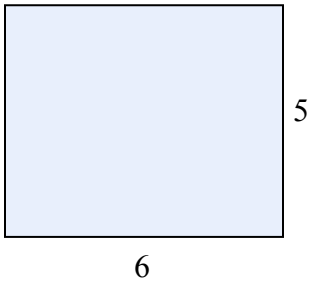

4)

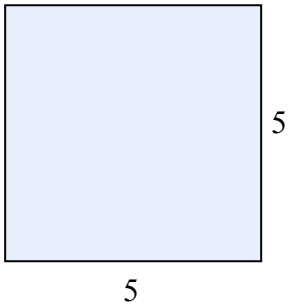

5)

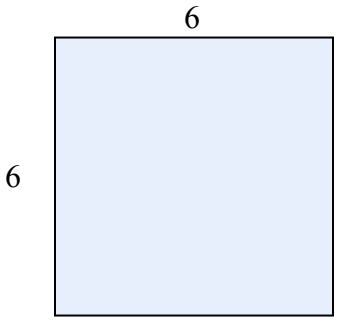

6)

7)

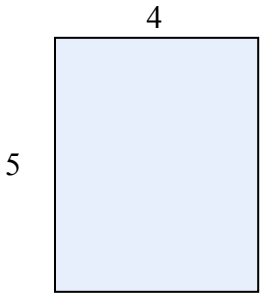

8)

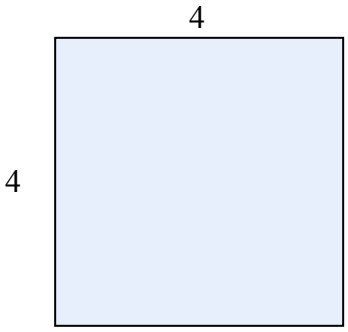

9)

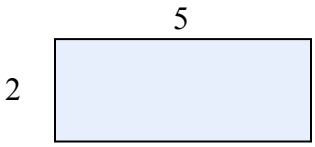

10)

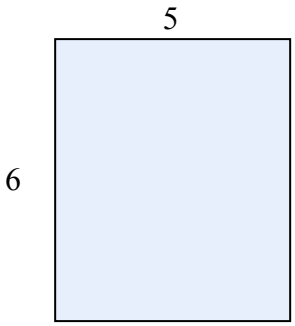

Ответы

1. _____
2. _____
3. _____
4. _____
5. _____
6. _____
7. _____
8. _____
9. _____
10. _____

Определение площади по секторам Имя: Ключ к правильным ответам

Определите площадь прямоугольников, разбивая на сектора. Первый уже разбит.

1)

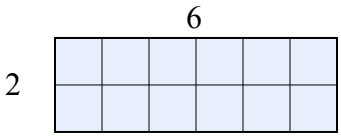

2)

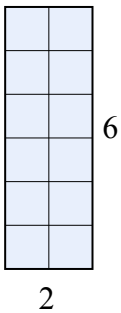

3)

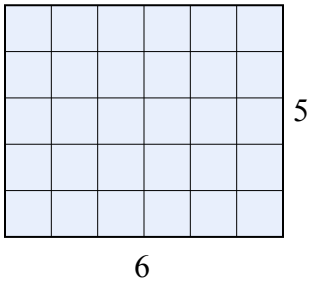

4)

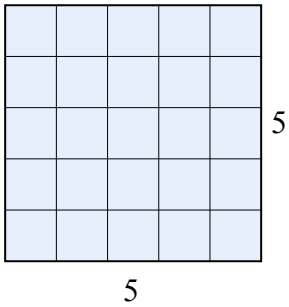

5)

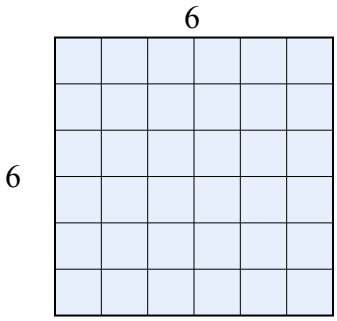

6)

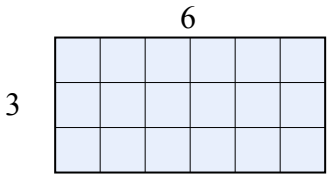

7)

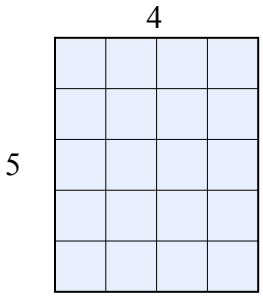

8)

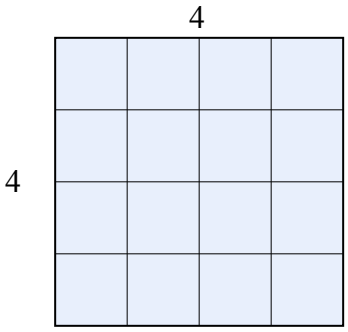

9)

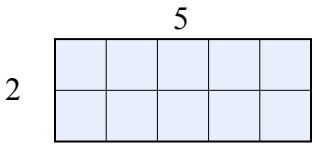

10)

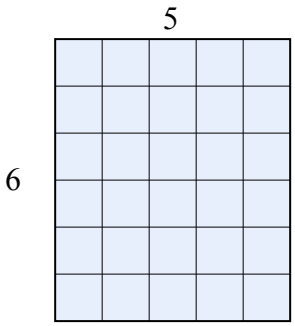

Ответы

1. 12
2. 12
3. 30
4. 25
5. 36
6. 18
7. 20
8. 16
9. 10
10. 30

1-10	90	80	70	60	50	40	30	20	10	0