Определение площади по секторам Имя:

Определите площадь прямоугольников, разбивая на сектора. Первый уже разбит.

1)

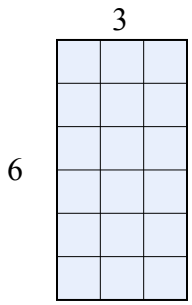

2)

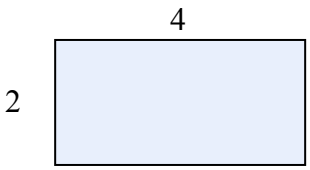

3)

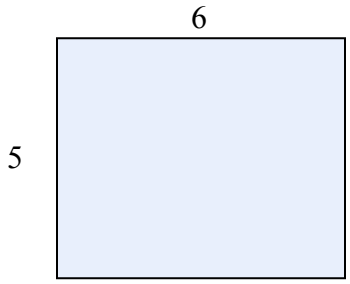

4)

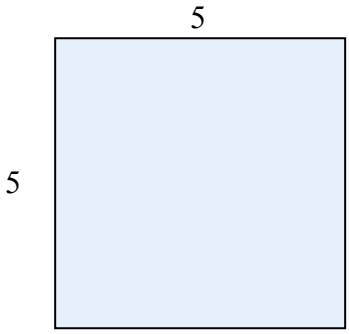

5)

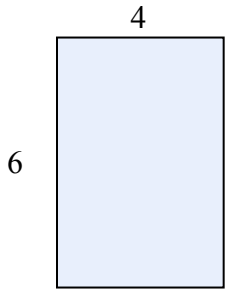

6)

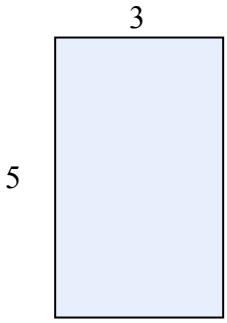

7)

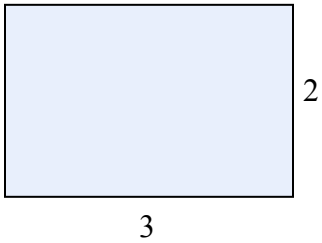

8)

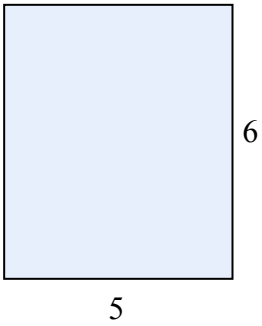

9)

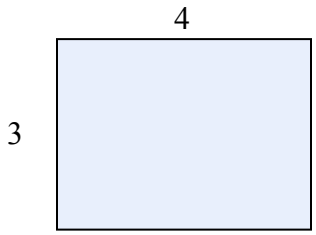

10)

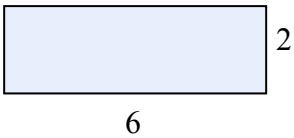

Ответы

1. _____
2. _____
3. _____
4. _____
5. _____
6. _____
7. _____
8. _____
9. _____
10. _____

1-10	90	80	70	60	50	40	30	20	10	0

Определение площади по секторам Имя: Ключ к правильным ответам

Определите площадь прямоугольников, разбивая на сектора. Первый уже разбит.

1)

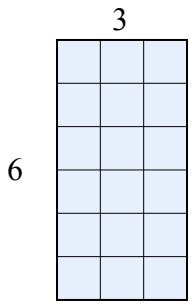

2)

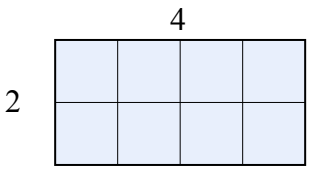

3)

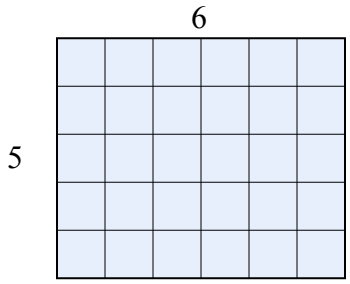

4)

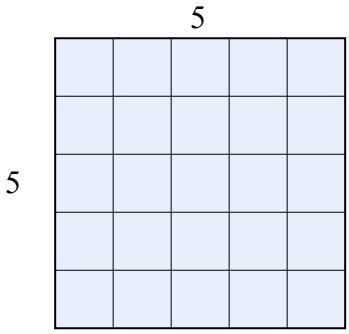

5)

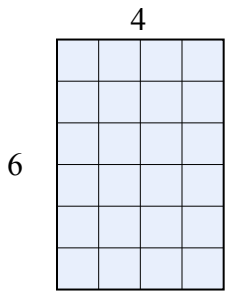

6)

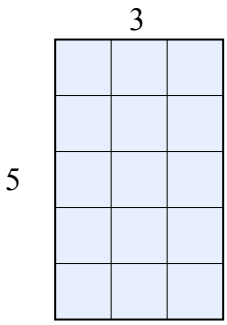

7)

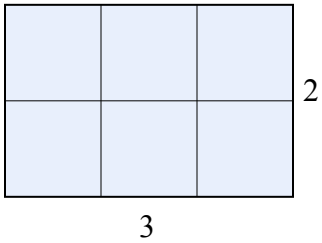

8)

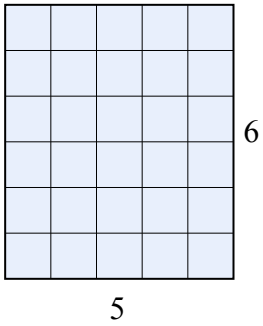

9)

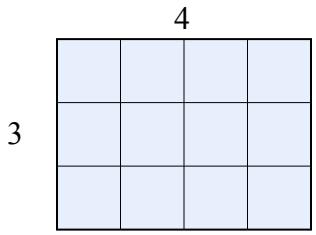

10)

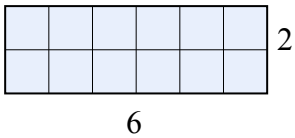

Ответы

1. 18
2. 8
3. 30
4. 25
5. 24
6. 15
7. 6
8. 30
9. 12
10. 12

1-10	90	80	70	60	50	40	30	20	10	0